Dividiendo con una recta numérica Nombre:

Usa la recta numérica para resolver cada problema. El primero ya está marcado como ejemplo.

1) $7 \div \frac{2}{4}$

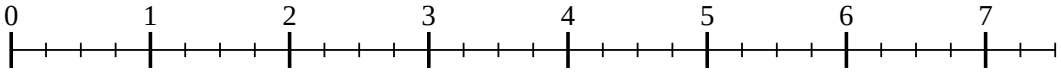

2) $7 \div \frac{2}{3}$

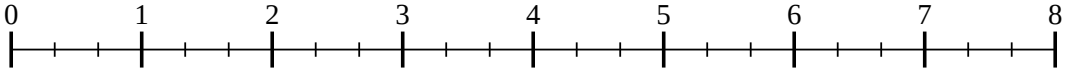

3) $2 \div \frac{2}{3}$



4) $6 \div \frac{2}{4}$

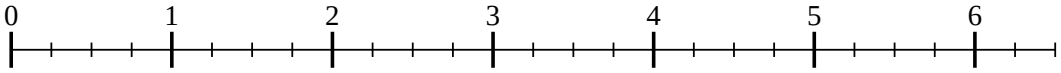

5) $4 \div \frac{2}{3}$

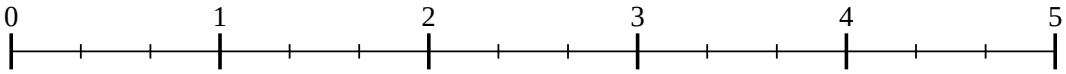

6) $4 \div \frac{3}{5}$

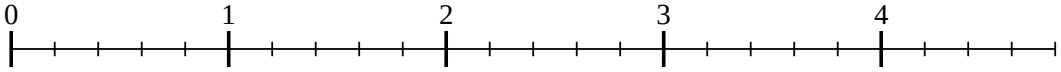

7) $5 \div \frac{4}{6}$

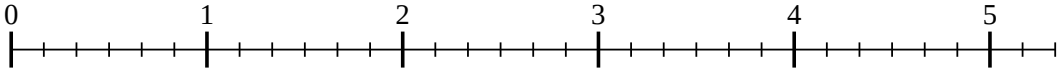

8) $6 \div \frac{2}{3}$

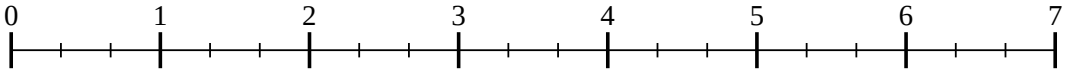

9) $7 \div \frac{2}{5}$

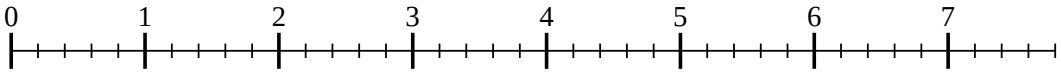

Respuestas

1. _____
2. _____
3. _____
4. _____
5. _____
6. _____
7. _____
8. _____
9. _____

1-9	89	78	67	56	44	33	22	11	0

Usa la recta numérica para resolver cada problema. El primero ya está marcado como ejemplo.

1) $7 \div \frac{2}{4}$

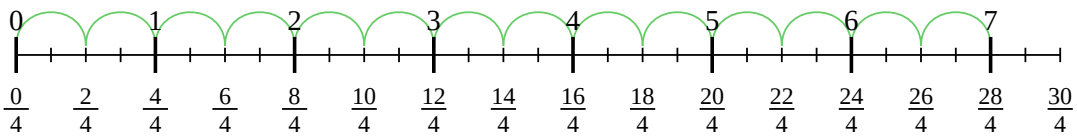

2) $7 \div \frac{2}{3}$

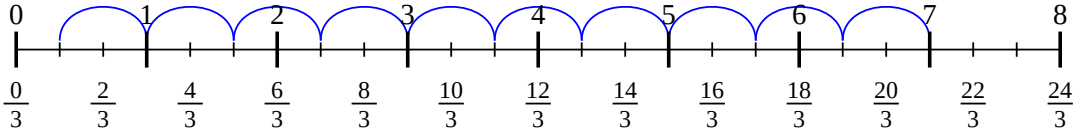

3) $2 \div \frac{2}{3}$

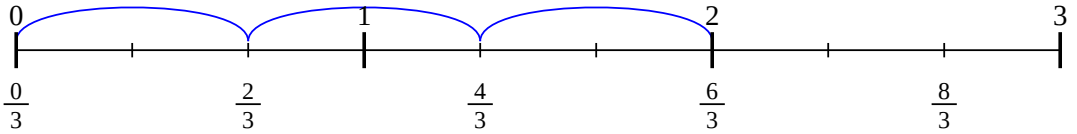

4) $6 \div \frac{2}{4}$

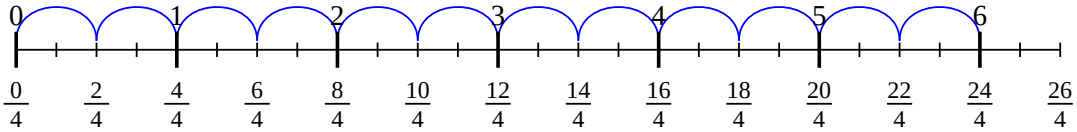

5) $4 \div \frac{2}{3}$

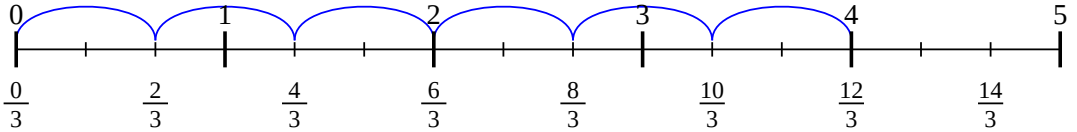

6) $4 \div \frac{3}{5}$

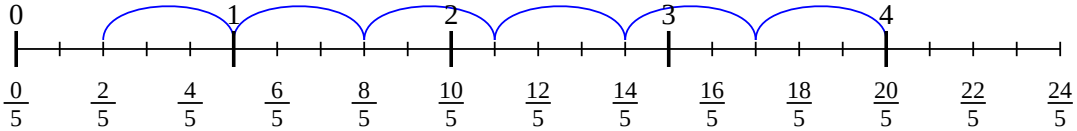

7) $5 \div \frac{4}{6}$

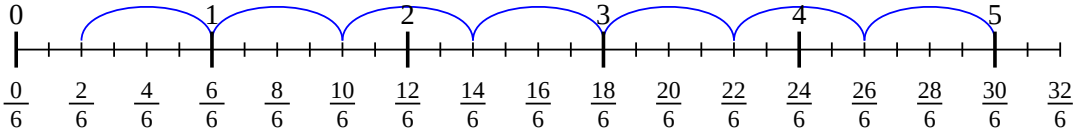

8) $6 \div \frac{2}{3}$

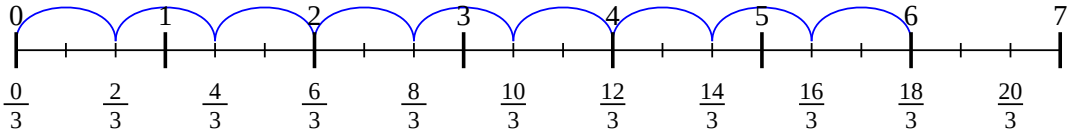

9) $7 \div \frac{2}{5}$

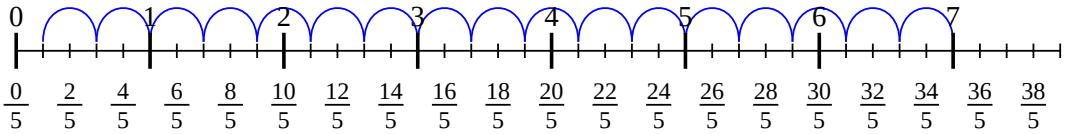

Respuestas

1. $\frac{28}{2}$
2. $\frac{21}{2}$
3. $\frac{6}{2}$
4. $\frac{24}{2}$
5. $\frac{12}{2}$
6. $\frac{20}{3}$
7. $\frac{30}{4}$
8. $\frac{18}{2}$
9. $\frac{35}{2}$

1-9	89	78	67	56	44	33	22	11	0