Restando Fracciones Mixtas (Visual)

Nombre:

Usa el modelo visual para resolver cada problema.

$4\,^{3}/_{5} - 2\,^{4}/_{5} = ?$

Para resolver un problema de resta de fracciones, una estrategia es sombrear primero la cantidad inicial ($4\,^{3}/_{5}$)

Em seguida, marque os inteiros (2).

Finalmente, marque la fracción $^{4}/_{5}$.

Ahora podemos ver que $4\,^{3}/_{5} - 2\,^{4}/_{5} = 1\,^{4}/_{5}$

1) $5\frac{2}{3} - 3\frac{2}{3} =$

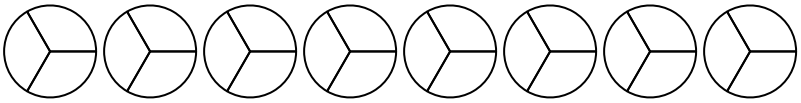

2) $3\frac{1}{4} - 1\frac{1}{4} =$

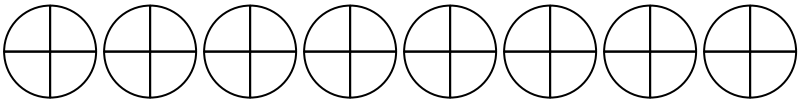

3) $7\frac{2}{5} - 2\frac{4}{5} =$

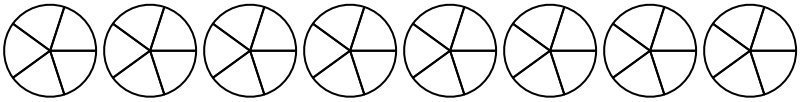

4) $4\frac{4}{5} - 2\frac{3}{5} =$

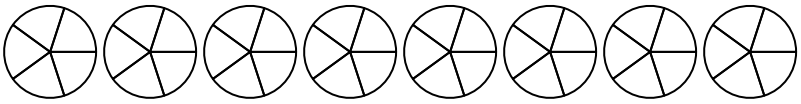

5) $3\frac{5}{10} - 1\frac{6}{10} =$

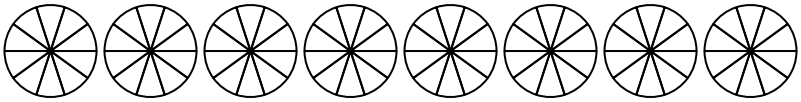

6) $6\frac{8}{10} - 4\frac{3}{10} =$

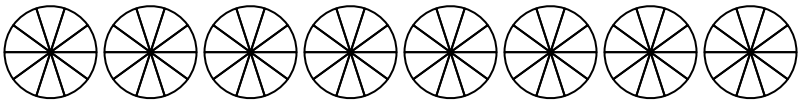

7) $4\frac{3}{4} - 1\frac{1}{4} =$

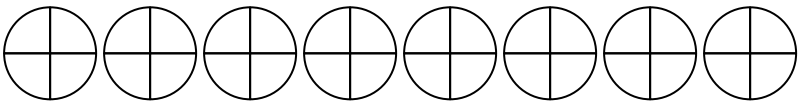

8) $5\frac{1}{3} - 2\frac{1}{3} =$

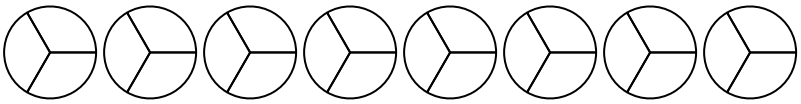

9) $5\frac{2}{4} - 3\frac{3}{4} =$

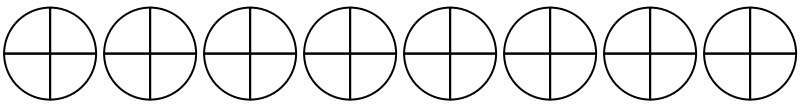

10) $4\frac{1}{3} - 1\frac{1}{3} =$

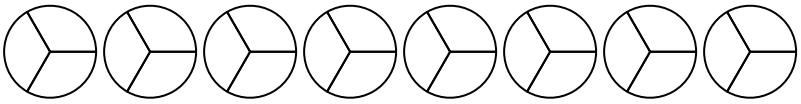

Respuestas

1. _____
2. _____
3. _____
4. _____
5. _____
6. _____
7. _____
8. _____
9. _____
10. _____

1-10	90	80	70	60	50	40	30	20	10	0

Restando Fracciones Mixtas (Visual)

Nombre: **Clave De Respuestas**

Usa el modelo visual para resolver cada problema.

$4\frac{3}{5} - 2\frac{4}{5} = ?$

Para resolver un problema de resta de fracciones, una estrategia es sombrear primero la cantidad inicial ($4\frac{3}{5}$)

Em seguida, marque os inteiros (2).

Finalmente, marque la fracción $\frac{4}{5}$.

Ahora podemos ver que $4\frac{3}{5} - 2\frac{4}{5} = 1\frac{4}{5}$

1) $5\frac{2}{3} - 3\frac{2}{3} =$

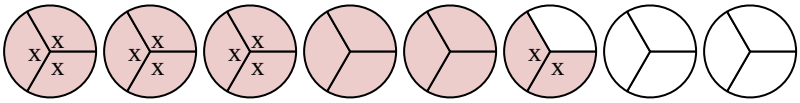

2) $3\frac{1}{4} - 1\frac{1}{4} =$

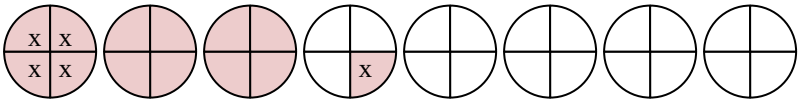

3) $7\frac{2}{5} - 2\frac{4}{5} =$

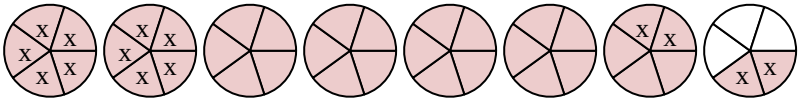

4) $4\frac{4}{5} - 2\frac{3}{5} =$

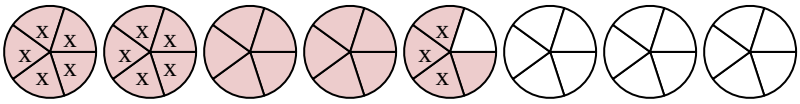

5) $3\frac{5}{10} - 1\frac{6}{10} =$

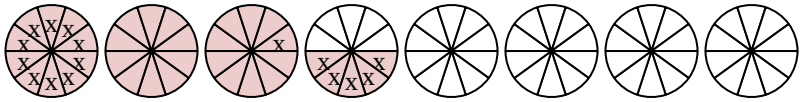

6) $6\frac{8}{10} - 4\frac{3}{10} =$

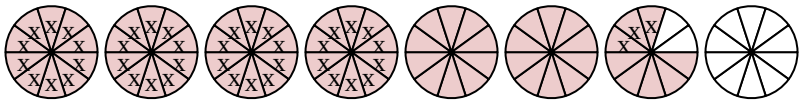

7) $4\frac{3}{4} - 1\frac{1}{4} =$

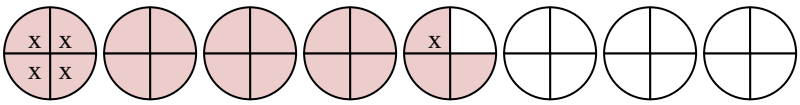

8) $5\frac{1}{3} - 2\frac{1}{3} =$

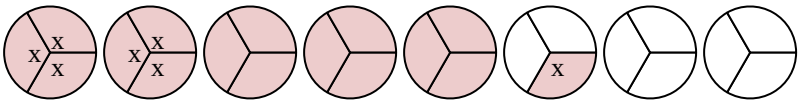

9) $5\frac{2}{4} - 3\frac{3}{4} =$

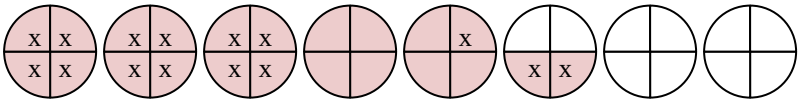

10) $4\frac{1}{3} - 1\frac{1}{3} =$

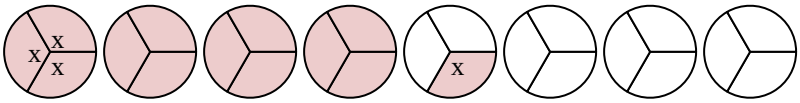

Respuestas

1. $2\frac{0}{3}$
2. $2\frac{0}{4}$
3. $4\frac{3}{5}$
4. $2\frac{1}{5}$
5. $1\frac{9}{10}$
6. $2\frac{5}{10}$
7. $3\frac{2}{4}$
8. $3\frac{0}{3}$
9. $1\frac{3}{4}$
10. $3\frac{0}{3}$

1-10	90	80	70	60	50	40	30	20	10	0