Restando Fracciones Mixtas (Visual)

Nombre:

Usa el modelo visual para resolver cada problema.

$4\,^{3}/_{5} - 2\,^{4}/_{5} = ?$

Para resolver un problema de resta de fracciones, una estrategia es sombrear primero la cantidad inicial ($4\,^{3}/_{5}$)

Em seguida, marque os inteiros (2).

Finalmente, marque la fracción $^{4}/_{5}$.

Ahora podemos ver que $4\,^{3}/_{5} - 2\,^{4}/_{5} = 1\,^{4}/_{5}$

1) $6\frac{8}{10} - 4\frac{1}{10} =$

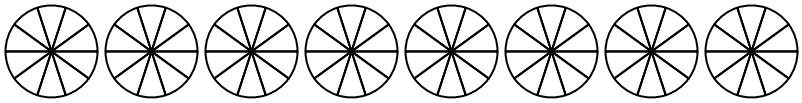

2) $6\frac{6}{8} - 1\frac{4}{8} =$

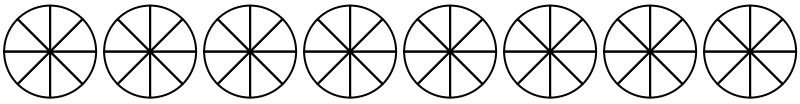

3) $4\frac{2}{8} - 2\frac{4}{8} =$

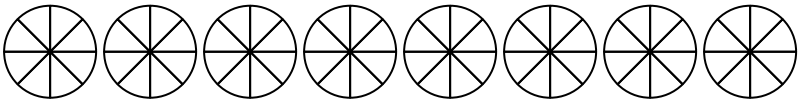

4) $3\frac{9}{12} - 1\frac{5}{12} =$

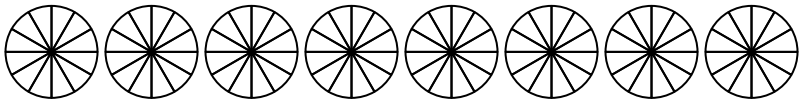

5) $4\frac{5}{8} - 1\frac{5}{8} =$

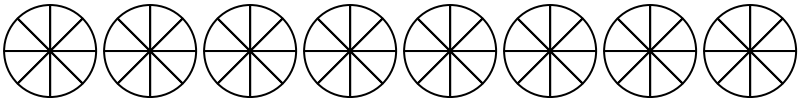

6) $4\frac{6}{8} - 2\frac{6}{8} =$

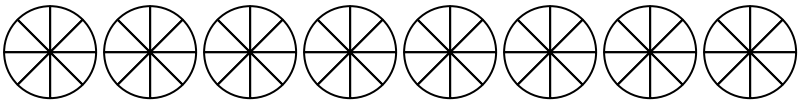

7) $4\frac{4}{5} - 2\frac{4}{5} =$

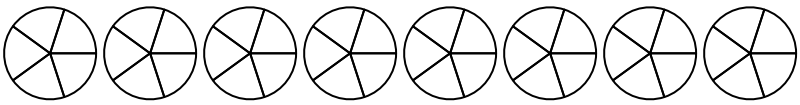

8) $3\frac{1}{8} - 1\frac{3}{8} =$

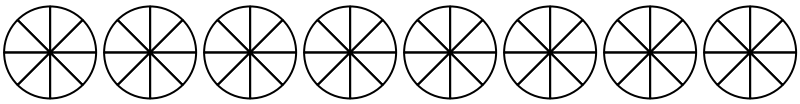

9) $3\frac{2}{6} - 1\frac{5}{6} =$

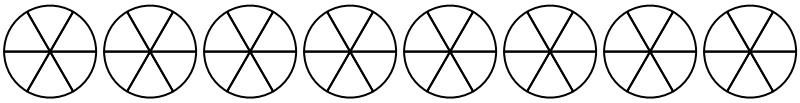

10) $3\frac{2}{8} - 1\frac{2}{8} =$

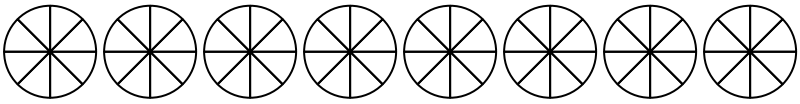

Respuestas

1. _____
2. _____
3. _____
4. _____
5. _____
6. _____
7. _____
8. _____
9. _____
10. _____

1-10	90	80	70	60	50	40	30	20	10	0

Usa el modelo visual para resolver cada problema.

$4\,{}^{3}\!/_{5} - 2\,{}^{4}\!/_{5} = ?$

Para resolver un problema de resta de fracciones, una estrategia es sombrear primero la cantidad inicial ($4\,{}^{3}\!/_{5}$)

Em seguida, marque os inteiros (2).

Finalmente, marque la fracción ${}^{4}\!/_{5}$.

Ahora podemos ver que $4\,{}^{3}\!/_{5} - 2\,{}^{4}\!/_{5} = 1\,{}^{4}\!/_{5}$

1) $6\frac{8}{10} - 4\frac{1}{10} =$

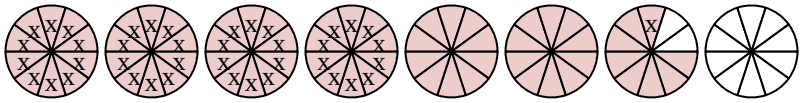

2) $6\frac{6}{8} - 1\frac{4}{8} =$

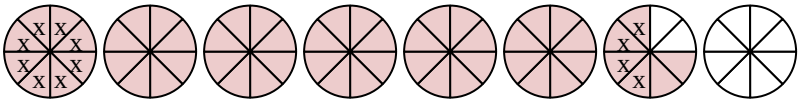

3) $4\frac{2}{8} - 2\frac{4}{8} =$

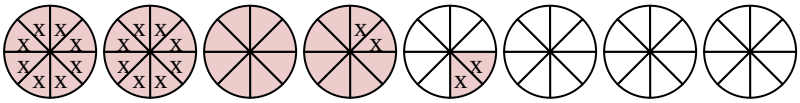

4) $3\frac{9}{12} - 1\frac{5}{12} =$

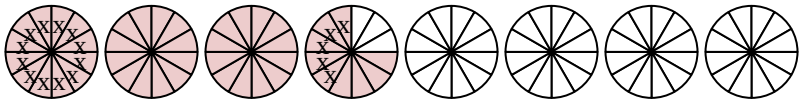

5) $4\frac{5}{8} - 1\frac{5}{8} =$

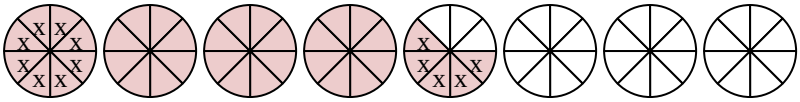

6) $4\frac{6}{8} - 2\frac{6}{8} =$

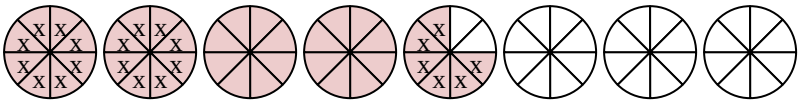

7) $4\frac{4}{5} - 2\frac{4}{5} =$

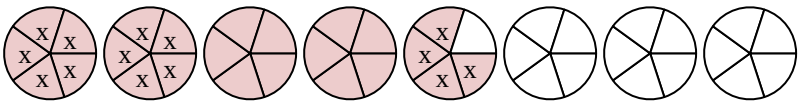

8) $3\frac{1}{8} - 1\frac{3}{8} =$

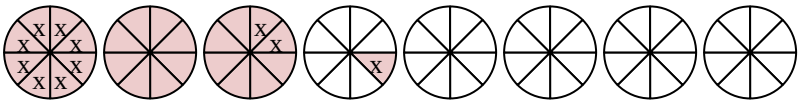

9) $3\frac{2}{6} - 1\frac{5}{6} =$

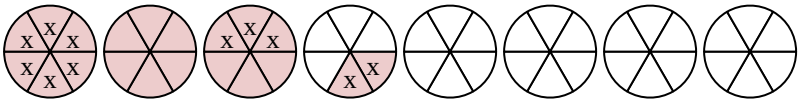

10) $3\frac{2}{8} - 1\frac{2}{8} =$

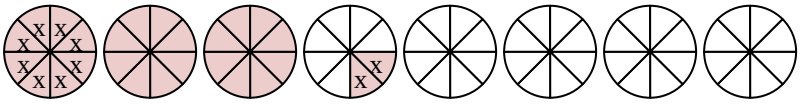

Respuestas

1. $2\,{}^{7}\!/_{10}$
2. $5\,{}^{2}\!/_{8}$
3. $1\,{}^{6}\!/_{8}$
4. $2\,{}^{4}\!/_{12}$
5. $3\,{}^{0}\!/_{8}$
6. $2\,{}^{0}\!/_{8}$
7. $2\,{}^{0}\!/_{5}$
8. $1\,{}^{6}\!/_{8}$
9. $1\,{}^{3}\!/_{6}$
10. $2\,{}^{0}\!/_{8}$

1-10	90	80	70	60	50	40	30	20	10	0