Crear rectángulos en una cuadrícula con coordenadas Nombre:

Encuentra las coordenadas del punto D para hacer un rectángulo.

Ej)

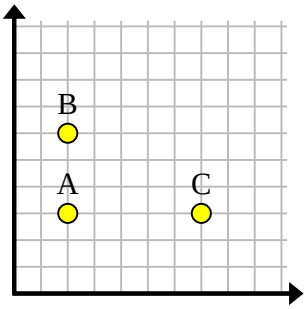

1)

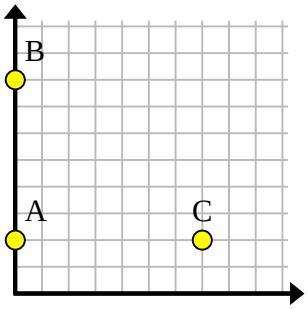

2)

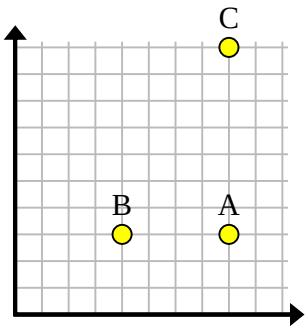

3)

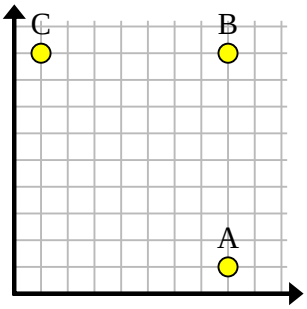

4)

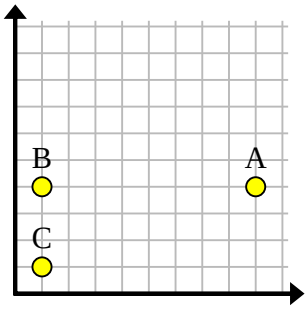

5)

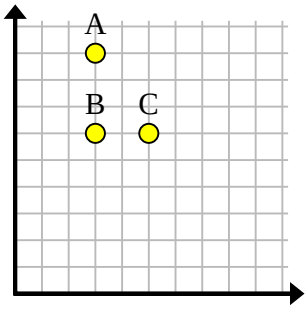

6)

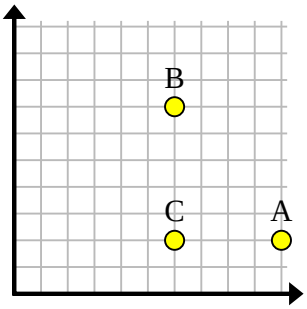

7)

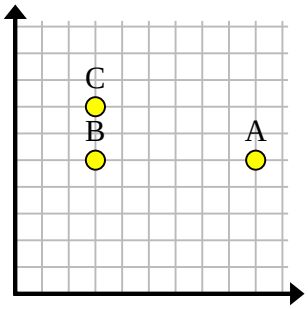

8)

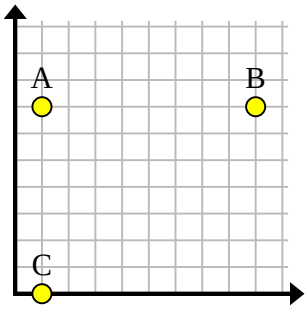

9)

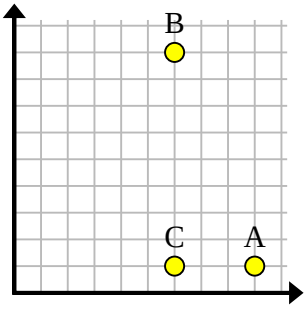

10)

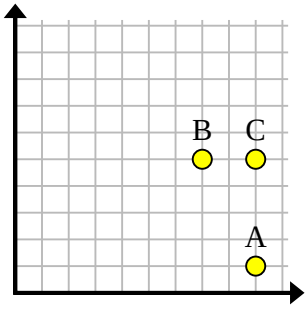

11)

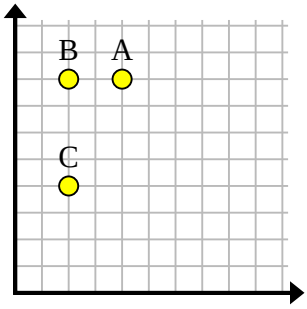

Respuestas

Ej. (7 , 6)

1. _____

2. _____

3. _____

4. _____

5. _____

6. _____

7. _____

8. _____

9. _____

10. _____

11. _____

1-10	91	82	73	64	55	45	36	27	18	9
11	0									

Encuentra las coordenadas del punto D para hacer un rectángulo.

Ej)

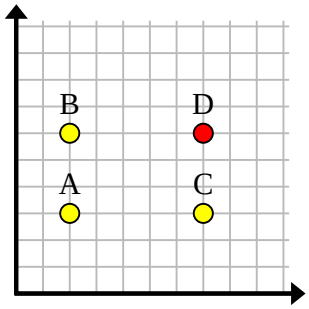

1)

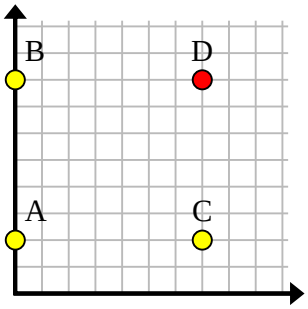

2)

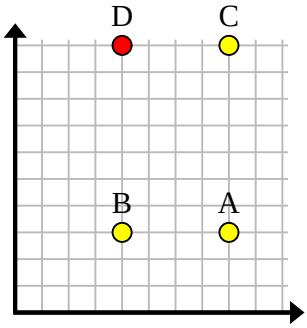

3)

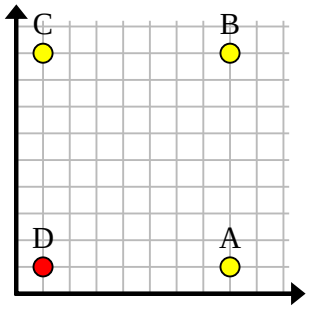

4)

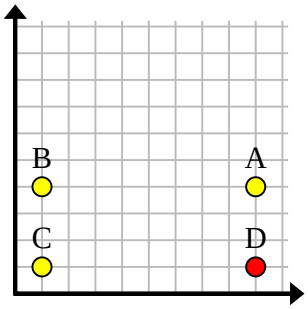

5)

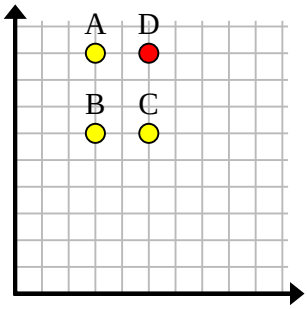

6)

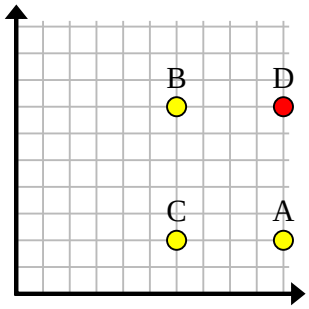

7)

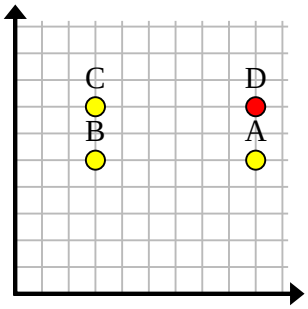

8)

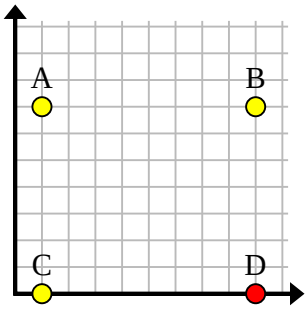

9)

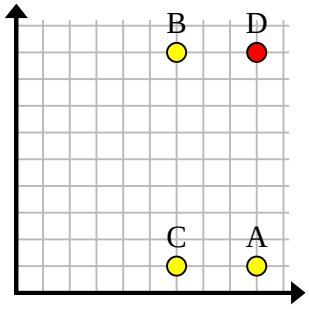

10)

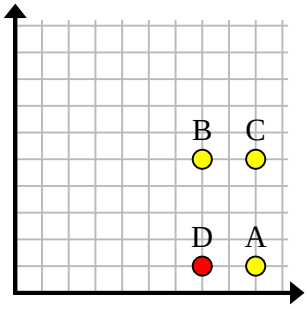

11)

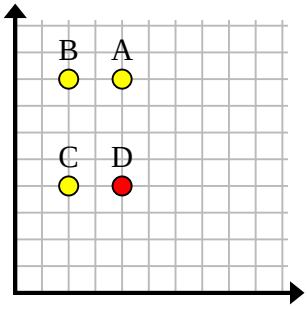

Respuestas

Ej.	(7 , 6)
1.	(7 , 8)
2.	(4 , 10)
3.	(1 , 1)
4.	(9 , 1)
5.	(5 , 9)
6.	(10 , 7)
7.	(9 , 7)
8.	(9 , 0)
9.	(9 , 9)
10.	(7 , 1)
11.	(4 , 4)

1-10	91	82	73	64	55	45	36	27	18	9
11	0									