Encontrando la distancia en un plano cartesiano Nombre:

Encuentra la distancia entre puntos.

Ej)

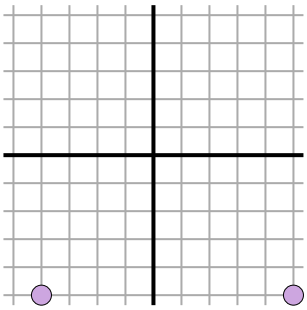

1)

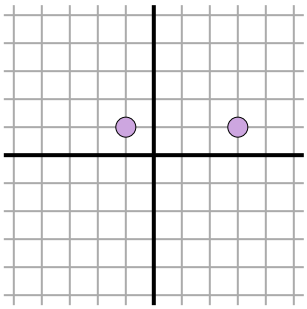

2)

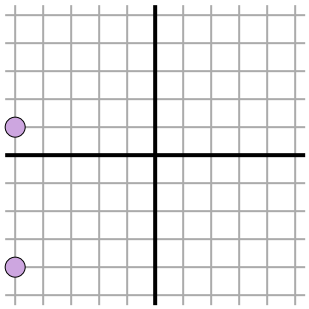

3)

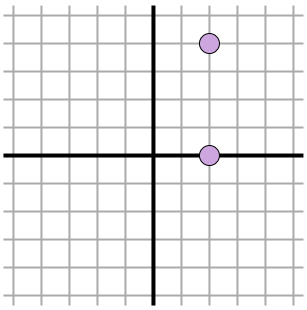

4)

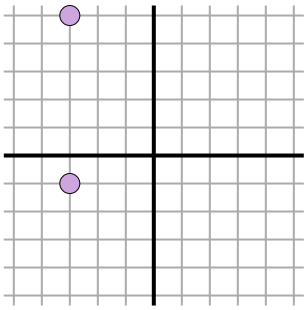

5)

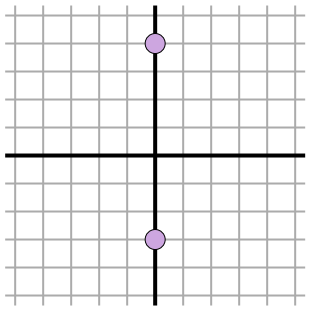

6)

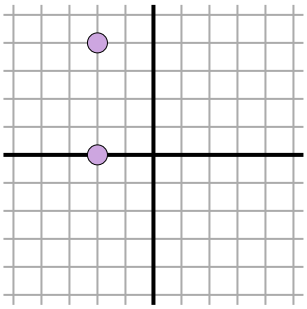

7)

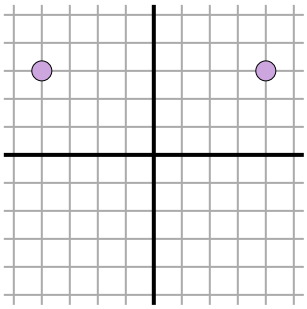

8)

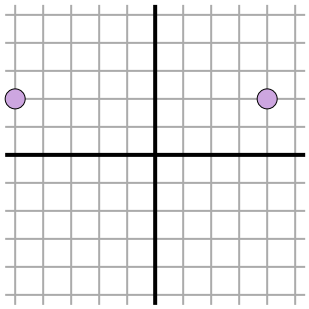

9)

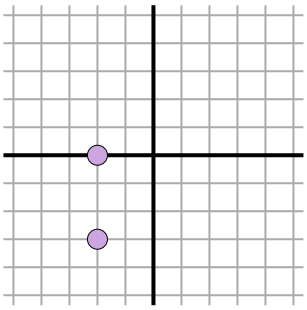

10)

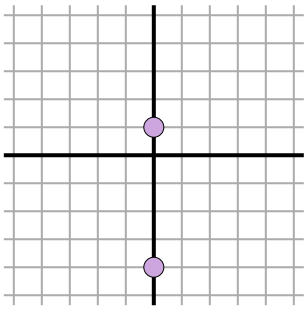

11)

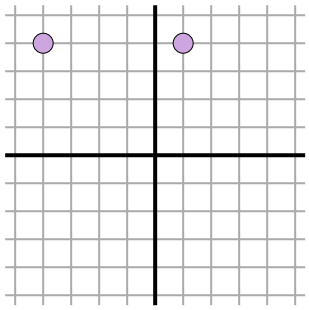

Respuestas

Ej. 9

1. _____
2. _____
3. _____
4. _____
5. _____
6. _____
7. _____
8. _____
9. _____
10. _____
11. _____

1-10	91	82	73	64	55	45	36	27	18	9
11	0									

Encuentra la distancia entre puntos.

Ej)

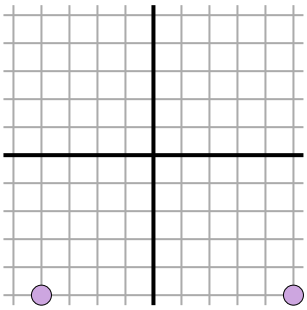

$\sqrt{(5--4)^2 + (-5--5)^2}$

$\sqrt{(81) + (0)}$

1)

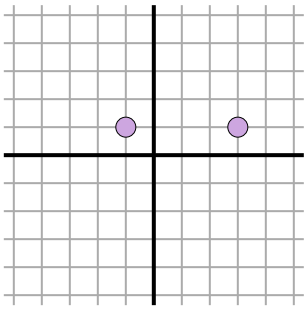

$\sqrt{(-1-3)^2 + (1-1)^2}$

$\sqrt{(16) + (0)}$

2)

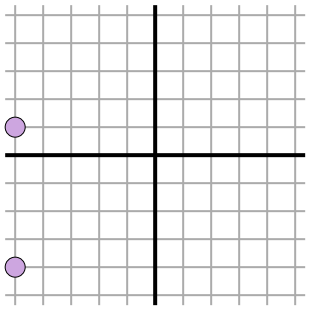

$\sqrt{(-5--5)^2 + (-4-1)^2}$

$\sqrt{(0) + (25)}$

3)

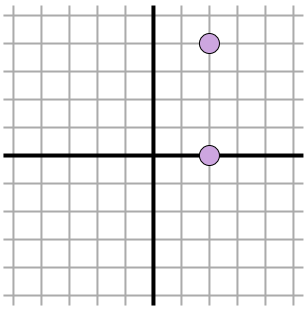

$\sqrt{(2-2)^2 + (0-4)^2}$

$\sqrt{(0) + (16)}$

4)

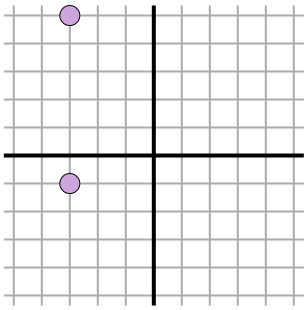

$\sqrt{(-3--3)^2 + (-1-5)^2}$

$\sqrt{(0) + (36)}$

5)

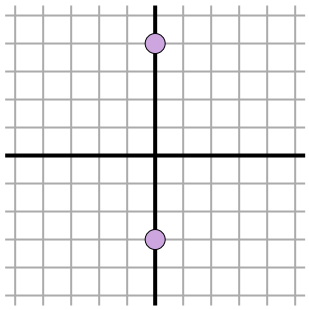

$\sqrt{(0-0)^2 + (4--3)^2}$

$\sqrt{(0) + (49)}$

6)

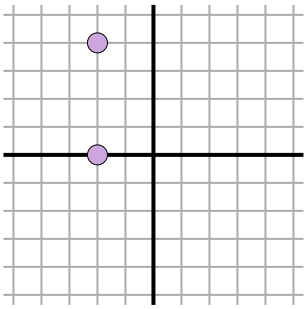

$\sqrt{(-2--2)^2 + (0-4)^2}$

$\sqrt{(0) + (16)}$

7)

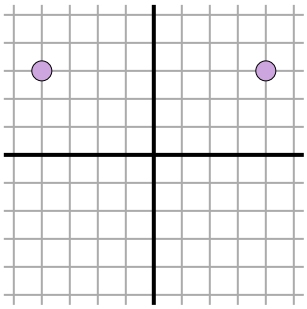

$\sqrt{(4--4)^2 + (3-3)^2}$

$\sqrt{(64) + (0)}$

8)

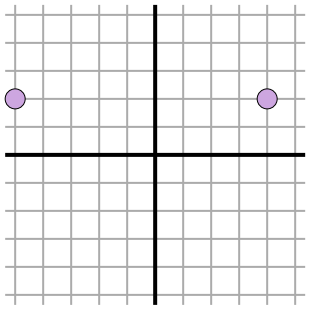

$\sqrt{(-5-4)^2 + (2-2)^2}$

$\sqrt{(81) + (0)}$

9)

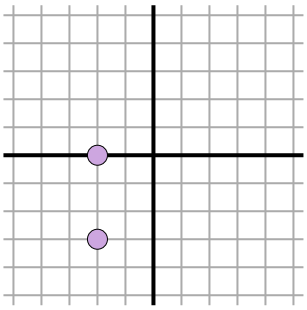

$\sqrt{(-2--2)^2 + (0--3)^2}$

$\sqrt{(0) + (9)}$

10)

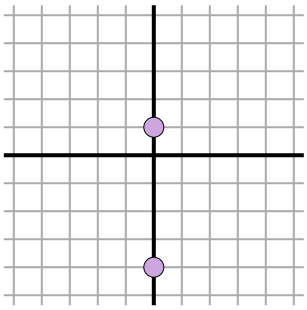

$\sqrt{(0-0)^2 + (1--4)^2}$

$\sqrt{(0) + (25)}$

11)

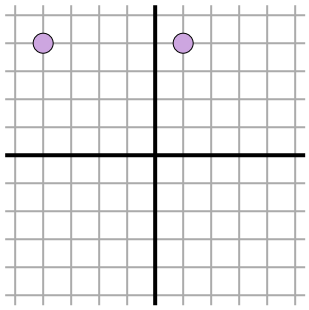

$\sqrt{(-4-1)^2 + (4-4)^2}$

$\sqrt{(25) + (0)}$

Respuestas

Ej.	9
1.	4
2.	5
3.	4
4.	6
5.	7
6.	4
7.	8
8.	9
9.	3
10.	5
11.	5

1-10	91	82	73	64	55	45	36	27	18	9
11	0									