Identificación de líneas Nombre:

Utilice 'paralelo', 'perpendicular' (perpendicular) o 'inter' (intersección) para describir las líneas.

1)

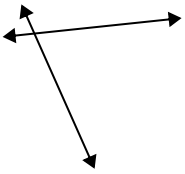

2)

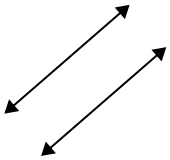

3)

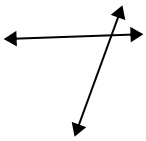

4)

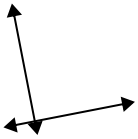

5)

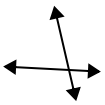

6)

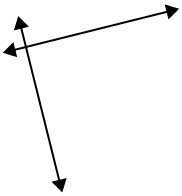

7)

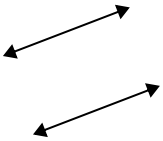

8)

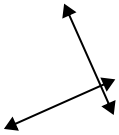

9)

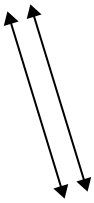

10)

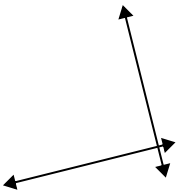

11)

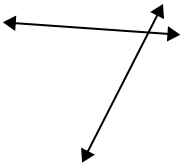

12)

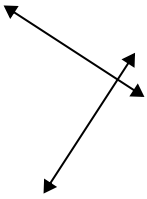

13)

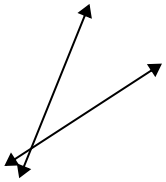

14)

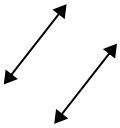

15)

Respuestas

1. _____
2. _____
3. _____
4. _____
5. _____
6. _____
7. _____
8. _____
9. _____
10. _____
11. _____
12. _____
13. _____
14. _____
15. _____

1-10	93	87	80	73	67	60	53	47	40	33
11-15	27	20	13	7	0					

Utilice 'paralelo', 'perpendicular' (perpendicular) o 'inter' (intersección) para describir las líneas.

1)

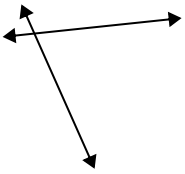

2)

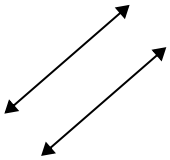

3)

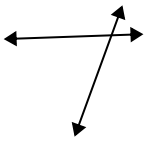

4)

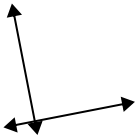

5)

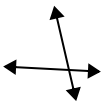

6)

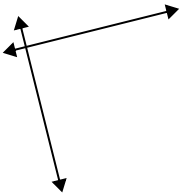

7)

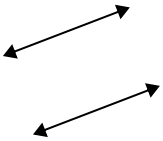

8)

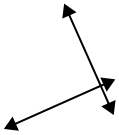

9)

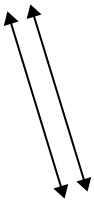

10)

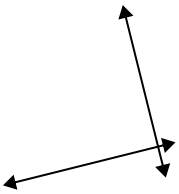

11)

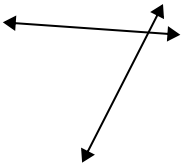

12)

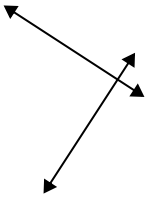

13)

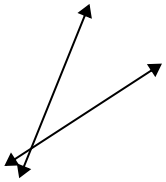

14)

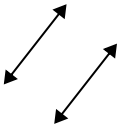

15)

Respuestas

1. inter
2. paralelo
3. inter
4. perp & inter
5. inter
6. perp & inter
7. paralelo
8. perp & inter
9. paralelo
10. perp & inter
11. inter
12. perp & inter
13. inter
14. paralelo
15. paralelo

1-10	93	87	80	73	67	60	53	47	40	33
11-15	27	20	13	7	0					