Estimando la Distancia (Anglosajón)

Nombre:

Determina qué letra mejor respresenta la longitud/altura.

Polegadas (in)	Pie (pies)	Jarda (jd)	Milla (mi)
Una pulgada es aproximadamente la distancia de la última articulación de su dedo.	Um pé mede 12 polegadas. O comprimento de uma régua.	1 jarda é o mesmo que 3 pés. Do chão até a maçaneta da porta são cerca de 1 jarda.	Uma milha equivale a 5.280 pés. A maioria das estradas principais tem pelo menos uma milha de comprimento.

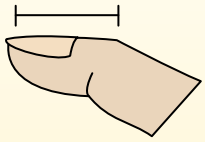
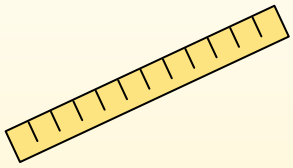
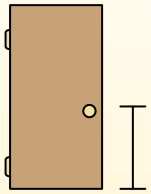

1)

Memoria {USB}
A. 2 pies
B. 6 pulgadas
C. 2 pulgadas
D. 11 pulgadas

2)



Montaña
A. 300 pulgadas
B. 2 miles
C. 10 yardas
D. 20 pies

3)



Chupete
A. 1 mile
B. 3 pulgadas
C. 5 pulgadas
D. 1 pie

4)

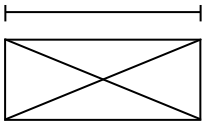

Sobre
A. 3 pulgadas
B. 7 pulgadas
C. 1 pie
D. 1 pulgada

5)

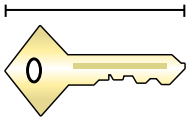

Llave
A. 2 pulgadas
B. 2 yardas
C. 5 pies
D. 6 pulgadas

6)

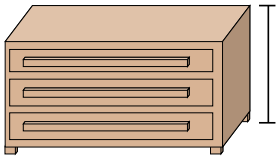

Comoda
A. 12 pulgadas
B. 18 pulgadas
C. 3 pies
D. 3 yardas

7)

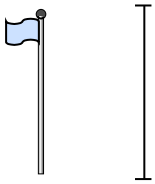

Asta de bandera
A. 5 pies
B. 10 yardas
C. 1 mile
D. 12 pulgadas

8)

Perro
A. 2 pies
B. 4 pulgadas
C. 2 yardas
D. 4 yardas

9)

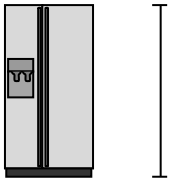

Refrigerador
A. 4 yardas
B. 6 pies
C. 12 pulgadas
D. 1 pie

Respuestas

1. _____
2. _____
3. _____
4. _____
5. _____
6. _____
7. _____
8. _____
9. _____

1-9	89	78	67	56	44	33	22	11	0

Estimando la Distancia (Anglosajón) Nombre: **Clave De Respuestas**

Determina qué letra mejor respresenta la longitud/altura.

Polegadas (in)	Pie (pies)	Jarda (jd)	Milla (mi)
Una pulgada es aproximadamente la distancia de la última articulación de su dedo.	Um pé mede 12 polegadas. O comprimento de uma régua.	1 jarda é o mesmo que 3 pés. Do chão até a maçaneta da porta são cerca de 1 jarda.	Uma milha equivale a 5.280 pés. A maioria das estradas principais tem pelo menos uma milha de comprimento.

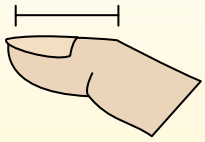
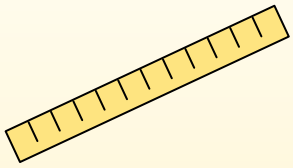
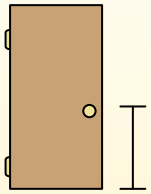

1)

Memoria {USB}
A. 2 pies
B. 6 pulgadas
C. 2 pulgadas
D. 11 pulgadas

2)



Montaña
A. 300 pulgadas
B. 2 miles
C. 10 yardas
D. 20 pies

3)



Chupete
A. 1 mile
B. 3 pulgadas
C. 5 pulgadas
D. 1 pie

4)

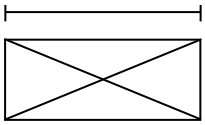

Sobre
A. 3 pulgadas
B. 7 pulgadas
C. 1 pie
D. 1 pulgada

5)

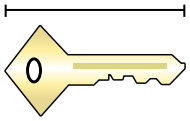

Llave
A. 2 pulgadas
B. 2 yardas
C. 5 pies
D. 6 pulgadas

6)

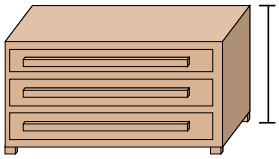

Comoda
A. 12 pulgadas
B. 18 pulgadas
C. 3 pies
D. 3 yardas

7)

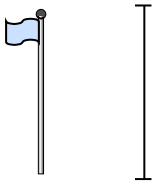

Asta de bandera
A. 5 pies
B. 10 yardas
C. 1 mile
D. 12 pulgadas

8)

Perro
A. 2 pies
B. 4 pulgadas
C. 2 yardas
D. 4 yardas

9)

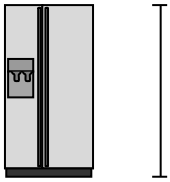

Refrigerador
A. 4 yardas
B. 6 pies
C. 12 pulgadas
D. 1 pie

Respuestas

1. C
2. B
3. C
4. B
5. A
6. C
7. B
8. A
9. B

1-9	89	78	67	56	44	33	22	11	0