Comparando las longitudes de objetos

Nombre:

Ordenar los objetos del más corto al más largo

1)

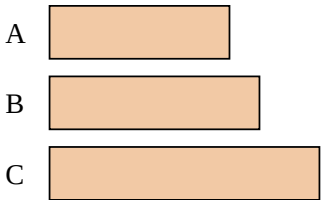

2)

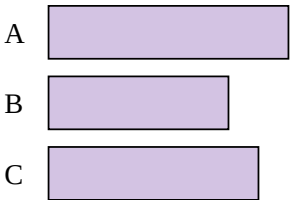

3)

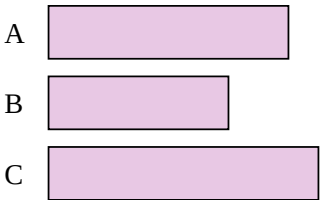

4)

5)

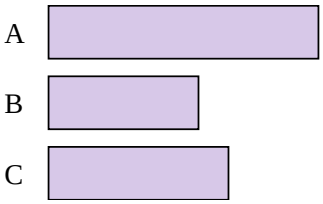

6)

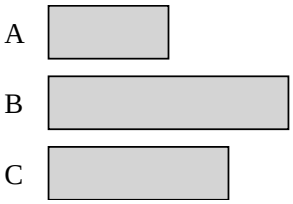

7)

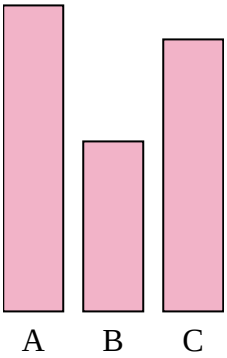

8)

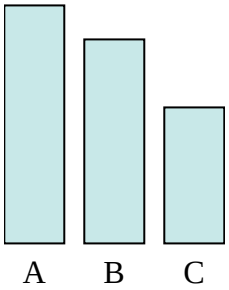

9)

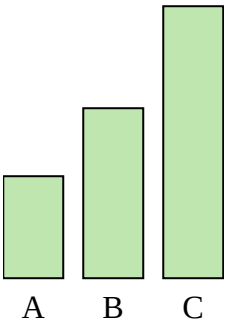

10)

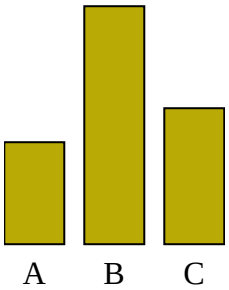

11)

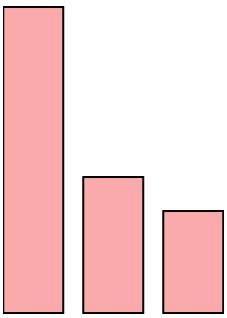

12)

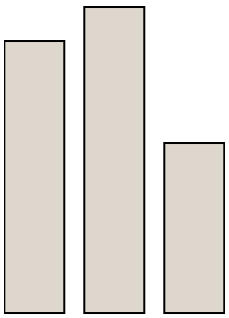

Respuestas

1. _____
2. _____
3. _____
4. _____
5. _____
6. _____
7. _____
8. _____
9. _____
10. _____
11. _____
12. _____

1-10	90	80	70	60	50	40	30	20	10	0

Comparando las longitudes de objetos

Nombre: **Clave De Respuestas**

Ordenar los objetos del más corto al más largo

1)

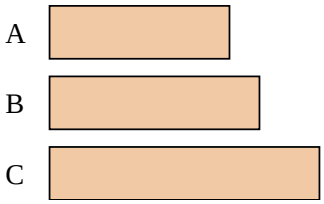

2)

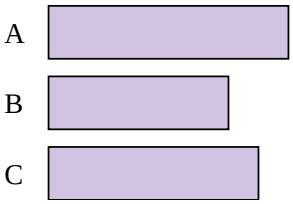

3)

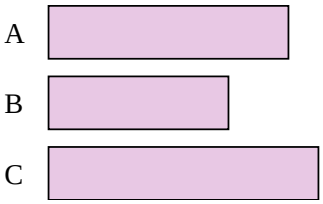

4)

5)

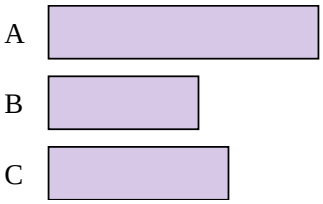

6)

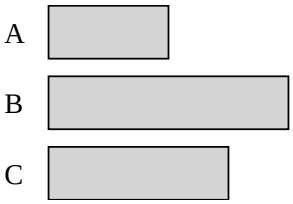

7)

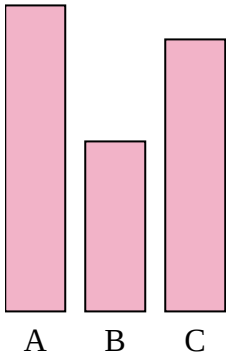

8)

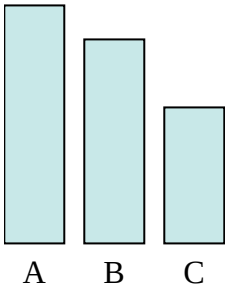

9)

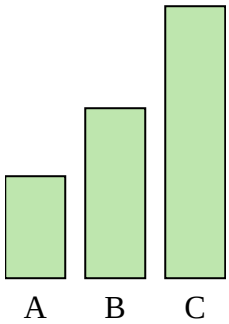

10)

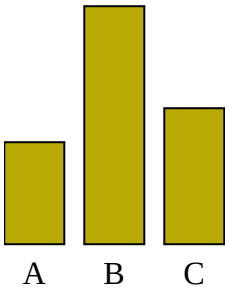

11)

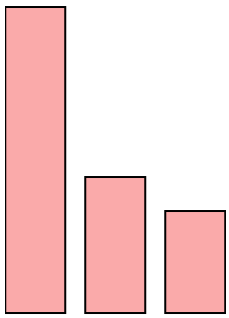

12)

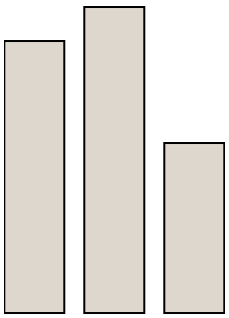

Respuestas

1. **A, B, C**
2. **B, C, A**
3. **B, A, C**
4. **A, C, B**
5. **B, C, A**
6. **A, C, B**
7. **B, C, A**
8. **C, B, A**
9. **A, B, C**
10. **A, C, B**
11. **C, B, A**
12. **C, A, B**

1-10	90	80	70	60	50	40	30	20	10	0