Medición y visualización de datos Nombre:

Mida cada ITEM punta a punta y luego coloque sus resultados en la gráfica de línea.

Ej) 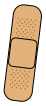

1) 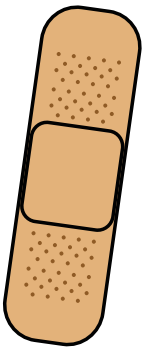

2)

3) 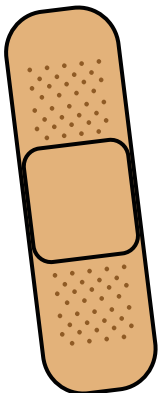

4) 

5) 

6)

7)

8) 

9) 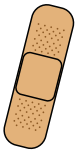

10) 

11) 

Line Plot

$\frac{1}{4}$	$\frac{1}{2}$	$\frac{3}{4}$	1	$1\frac{1}{4}$	$1\frac{1}{2}$	$1\frac{3}{4}$	2

Respuestas

Ej. $\frac{1}{2}$

1. _____
2. _____
3. _____
4. _____
5. _____
6. _____
7. _____
8. _____
9. _____
10. _____
11. _____

1-10	91	82	73	64	55	45	36	27	18	9
11	0									

Medición y visualización de datos

Nombre: **Clave De Respuestas**

Mida cada ITEM punta a punta y luego coloque sus resultados en la gráfica de línea.

Ej) 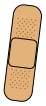

1) 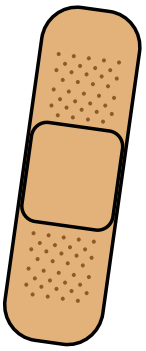

2)

3) 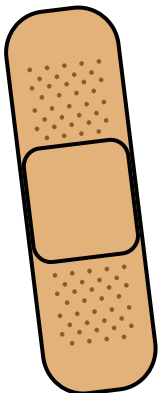

4) 

5) 

6)

7)

8) 

9) 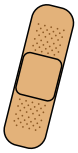

10) 

11) 

Line Plot

		X		X	X	X	
X	X	X	X	X	X	X	X
¼	½	¾	1	1 ¼	1 ½	1 ¾	2

Respuestas

Ej.	½
1.	1 ¾
2.	1
3.	2
4.	1 ¼
5.	1 ½
6.	¾
7.	¼
8.	1 ¼
9.	¾
10.	1 ¾
11.	1 ½

1-10	91	82	73	64	55	45	36	27	18	9
11	0									

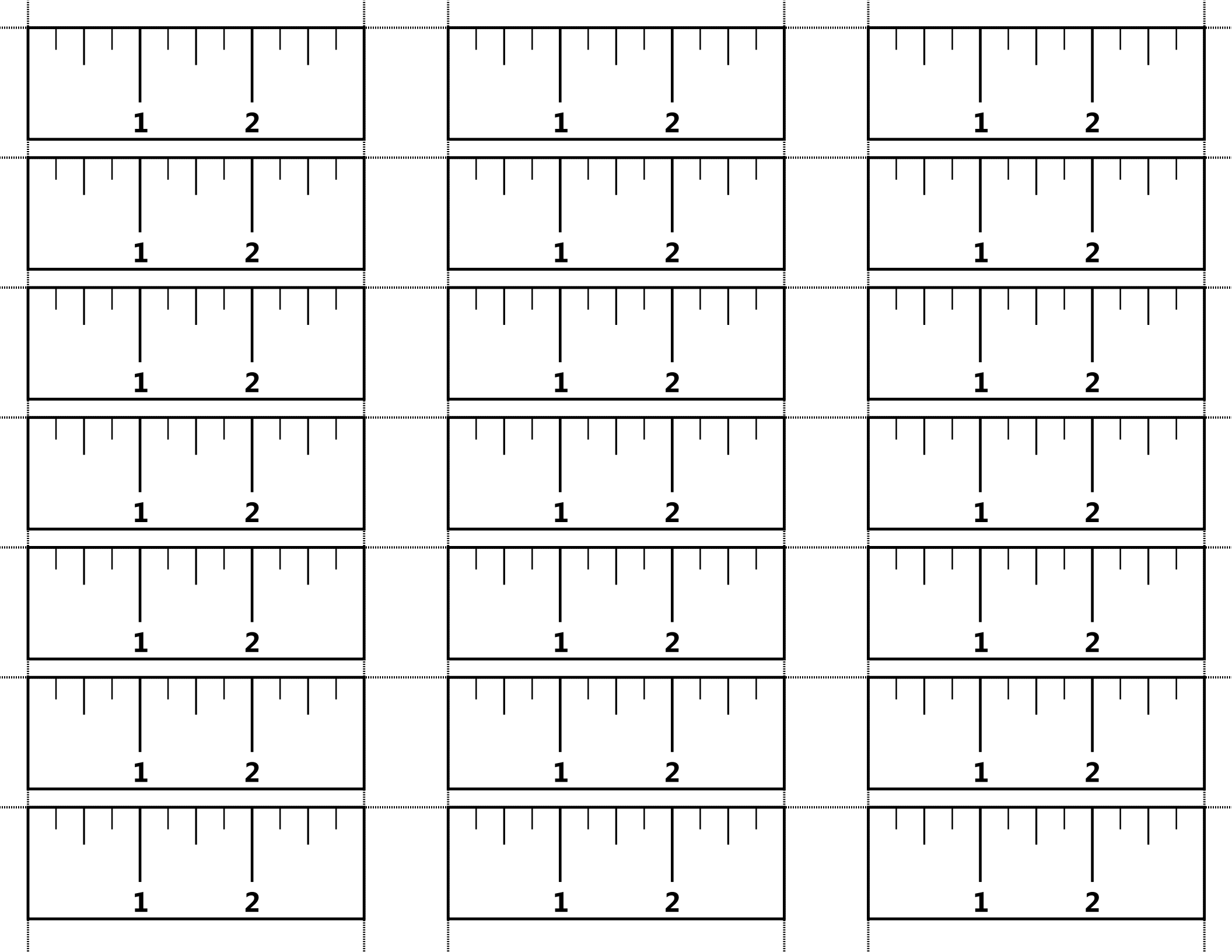
1
2