Matrices rectangulares

Nombre:

Escribir una ecuación para expresar los grupos y después encontrar el número de figuras.

Ej) 

1) 

2)

3)

4)

5) 

6) 

7)

8) 

9) 

10) 

11)

12)

13)

14) 

Respuestas

Ej. $2 \times 3 = 6$

1. _____
2. _____
3. _____
4. _____
5. _____
6. _____
7. _____
8. _____
9. _____
10. _____
11. _____
12. _____
13. _____
14. _____

1-10	93	86	79	71	64	57	50	43	36	29
11-14	21	14	7	0						

Escribir una ecuación para expresar los grupos y después encontrar el número de figuras.

Ej) 

1) 

2)

3)

4)

5) 

6) 

7)

8) 

9) 

10) 

11)

12)

13)

14) 

Respuestas

Ej. $2 \times 3 = 6$

1. $3 \times 5 = 15$
2. $3 \times 3 = 9$
3. $2 \times 5 = 10$
4. $3 \times 2 = 6$
5. $4 \times 3 = 12$
6. $4 \times 4 = 16$
7. $4 \times 2 = 8$
8. $3 \times 4 = 12$
9. $5 \times 5 = 25$
10. $4 \times 5 = 20$
11. $5 \times 2 = 10$
12. $2 \times 4 = 8$
13. $2 \times 2 = 4$
14. $5 \times 4 = 20$

1-10	93	86	79	71	64	57	50	43	36	29
11-14	21	14	7	0						