División de Rectángulos

Nombre:

Dividir la forma que se muestra y después cuenta para encontrar el número de cajas.

Las filas van de izquierda a derecha.

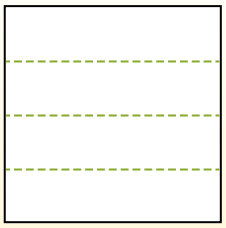

Las columnas van de arriba a abajo.

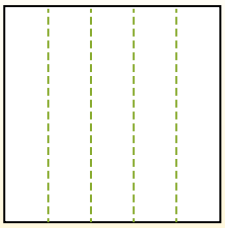

Aqui tem 4 linhas e 5 colunas . Existem 20 caixas no total.

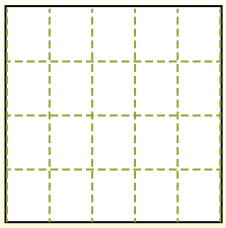

1) 5 filas
4 columnas

2) 4 filas
4 columnas

3) 2 filas
3 columnas

4) 4 filas
3 columnas

5) 5 filas
5 columnas

6) 3 filas
5 columnas

7) 5 filas
2 columnas

8) 2 filas
5 columnas

9) 3 filas
3 columnas

Respuestas

1. _____
2. _____
3. _____
4. _____
5. _____
6. _____
7. _____
8. _____
9. _____

1-9	89	78	67	56	44	33	22	11	0

Dividir la forma que se muestra y después cuenta para encontrar el número de cajas.

Las filas van de izquierda a derecha.

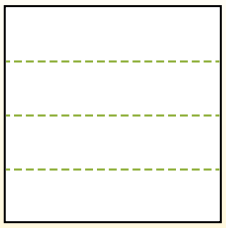

Las columnas van de arriba a abajo.

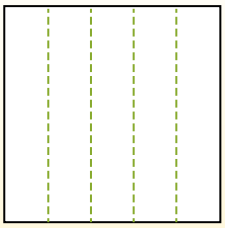

Aqui tem 4 linhas e 5 colunas . Existem 20 caixas no total.

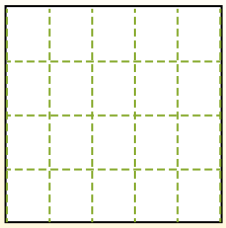

1) 5 filas
4 columnas

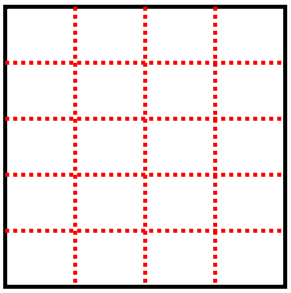

2) 4 filas
4 columnas

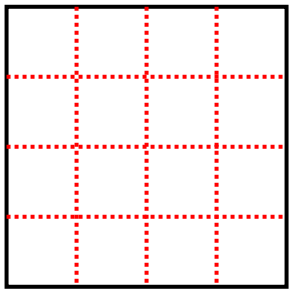

3) 2 filas
3 columnas

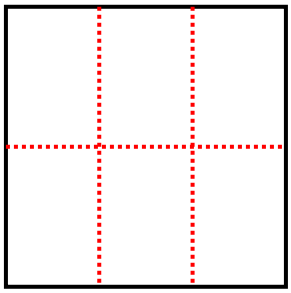

4) 4 filas
3 columnas

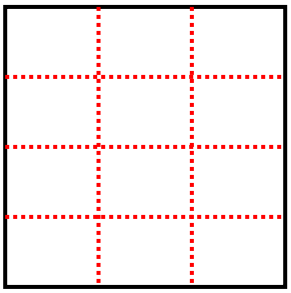

5) 5 filas
5 columnas

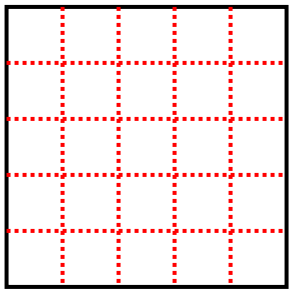

6) 3 filas
5 columnas

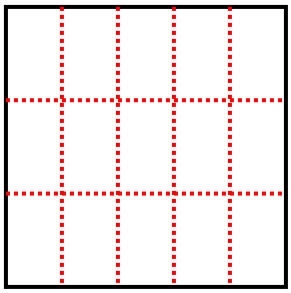

7) 5 filas
2 columnas

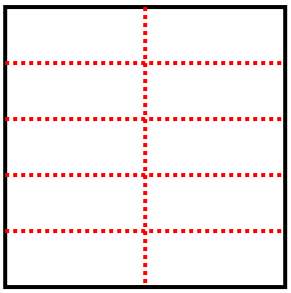

8) 2 filas
5 columnas

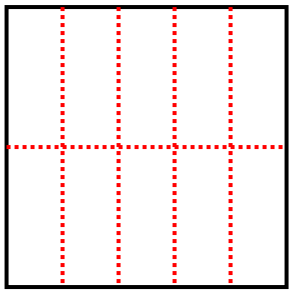

9) 3 filas
3 columnas

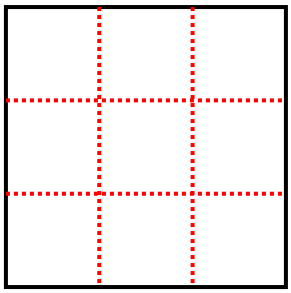

Respuestas

1. **20**
2. **16**
3. **6**
4. **12**
5. **25**
6. **15**
7. **10**
8. **10**
9. **9**

1-9	89	78	67	56	44	33	22	11	0