Máquinas de Funciones - (Sumar y Restar) Nombre:

Determina la regla que cada máquina de función está usando.

Ej)

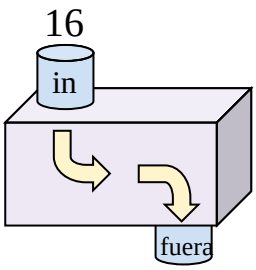

Agregar 12

1)

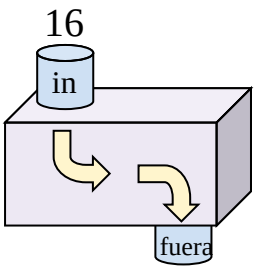

2)

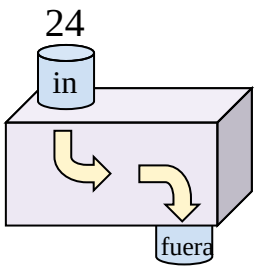

3)

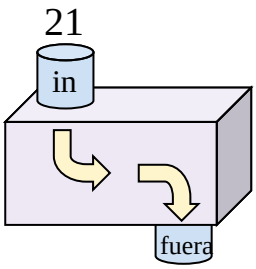

4)

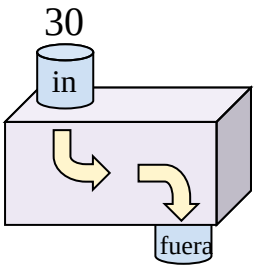

5)

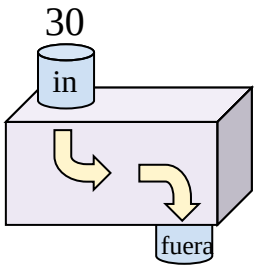

6)

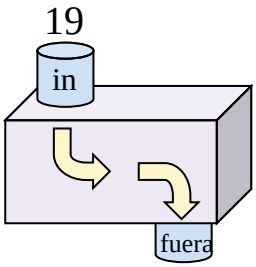

7)

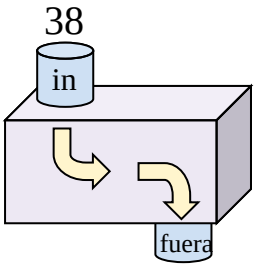

8)

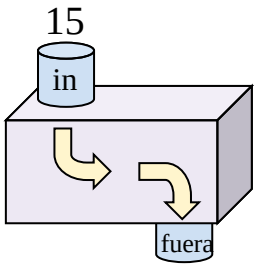

9)

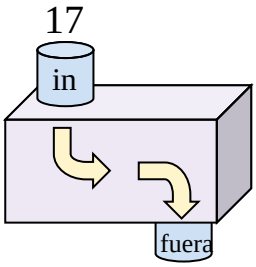

10)

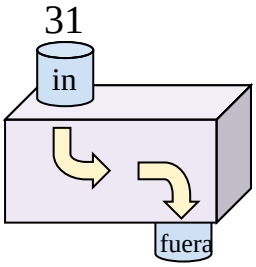

11)

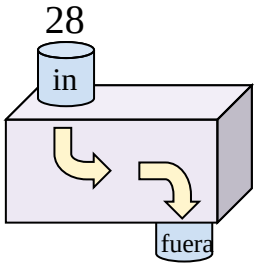

Respuestas

Ej. **Agregar 12**

1. _____
2. _____
3. _____
4. _____
5. _____
6. _____
7. _____
8. _____
9. _____
10. _____
11. _____

1-10	91	82	73	64	55	45	36	27	18	9
11	0									

Determina la regla que cada máquina de función está usando.

Ej)

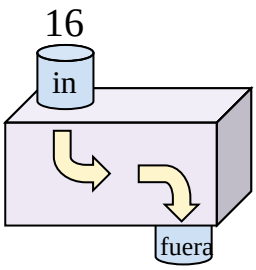

Agregar 12

1)

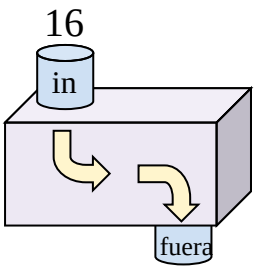

Agregar 6

2)

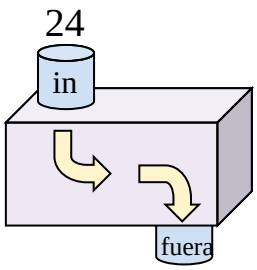

Restar 17

3)

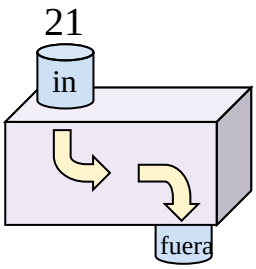

Agregar 14

4)

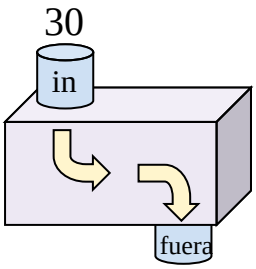

Restar 17

5)

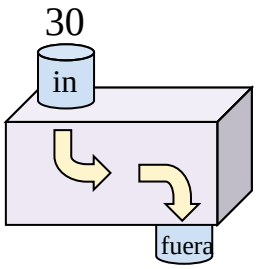

Restar 7

6)

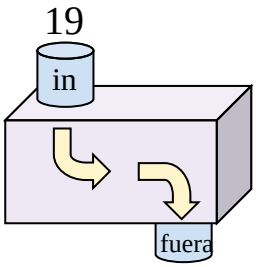

Agregar 13

7)

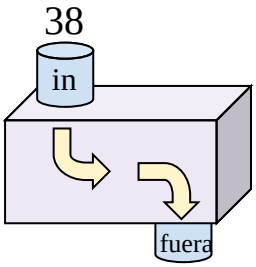

Restar 17

8)

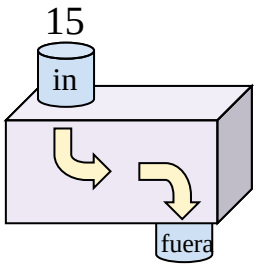

Agregar 8

9)

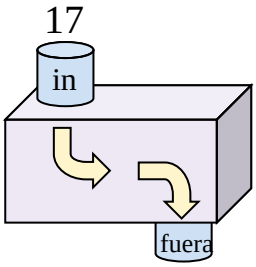

Agregar 15

10)

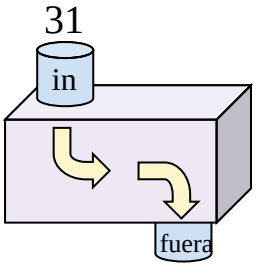

Restar 24

11)

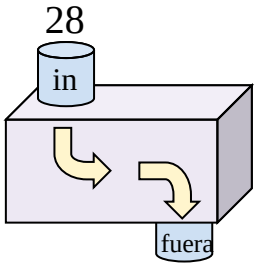

Restar 18

Respuestas

Ej.	Agregar 12
1.	Agregar 6
2.	Restar 17
3.	Agregar 14
4.	Restar 17
5.	Restar 7
6.	Agregar 13
7.	Restar 17
8.	Agregar 8
9.	Agregar 15
10.	Restar 24
11.	Restar 18

1-10	91	82	73	64	55	45	36	27	18	9
11	0									

Máquinas de Funciones - (Sumar y Restar) Nombre:

Determina la regla que cada máquina de función está usando.

Ej)

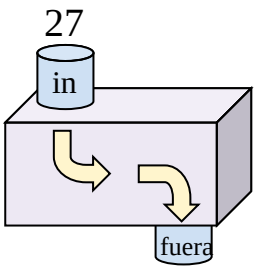

Restar 5

1)

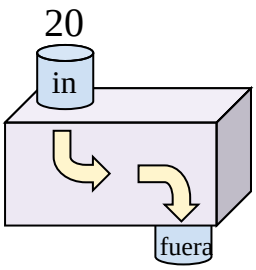

2)

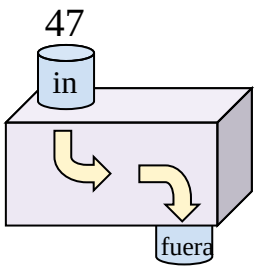

3)

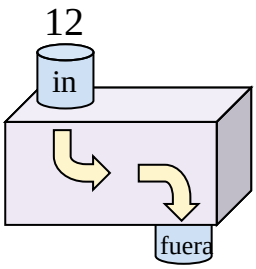

4)

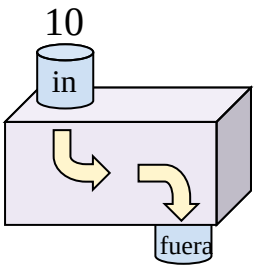

5)

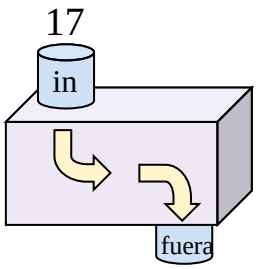

6)

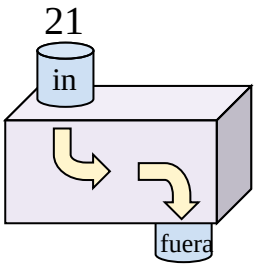

7)

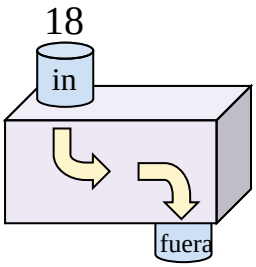

8)

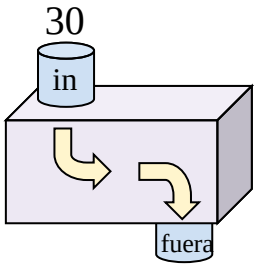

9)

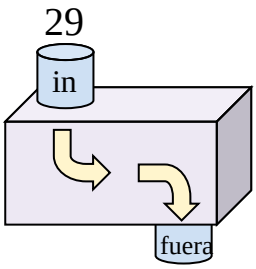

10)

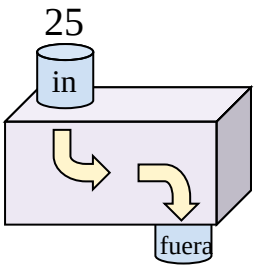

11)

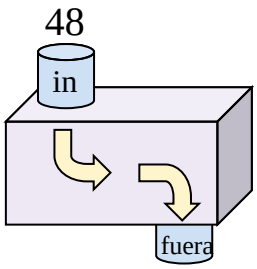

Respuestas

Ej. Restar 5

1. _____
2. _____
3. _____
4. _____
5. _____
6. _____
7. _____
8. _____
9. _____
10. _____
11. _____

1-10	91	82	73	64	55	45	36	27	18	9
11	0									

Determina la regla que cada máquina de función está usando.

Ej)

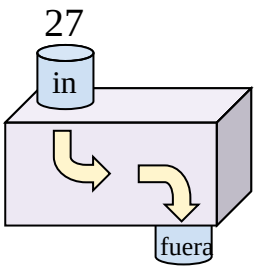

Restar 5

1)

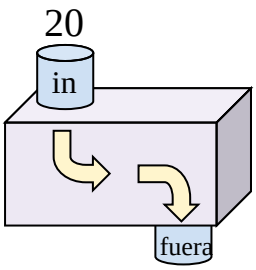

Agregar 14

2)

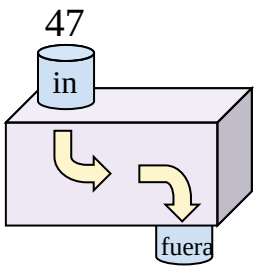

Restar 33

3)

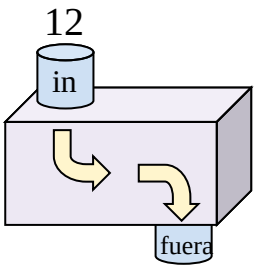

Agregar 27

4)

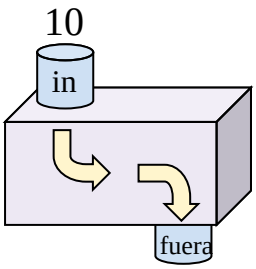

Agregar 30

5)

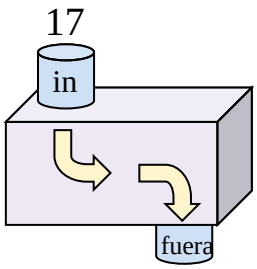

Agregar 25

6)

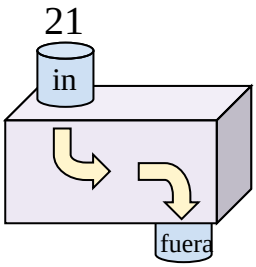

Agregar 24

7)

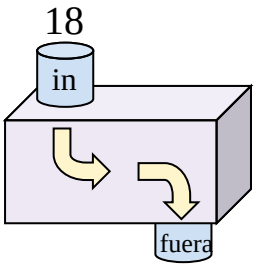

Restar 12

8)

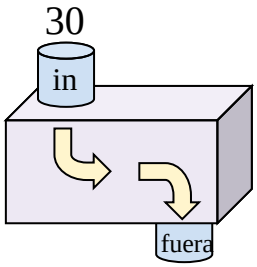

Restar 6

9)

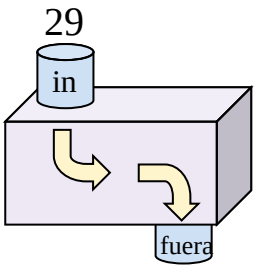

Agregar 18

10)

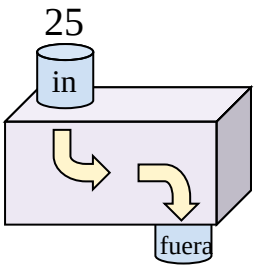

Agregar 5

11)

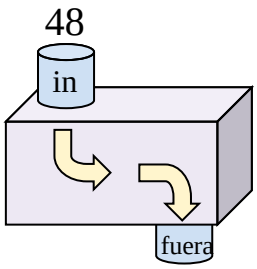

Restar 31

Respuestas

Ej. **Restar 5**

1. **Agregar 14**
2. **Restar 33**
3. **Agregar 27**
4. **Agregar 30**
5. **Agregar 25**
6. **Agregar 24**
7. **Restar 12**
8. **Restar 6**
9. **Agregar 18**
10. **Agregar 5**
11. **Restar 31**

1-10	91	82	73	64	55	45	36	27	18	9
11	0									

Máquinas de Funciones - (Sumar y Restar) Nombre:

Determina la regla que cada máquina de función está usando.

Ej)

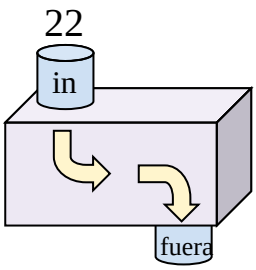

Agregar 20

1)

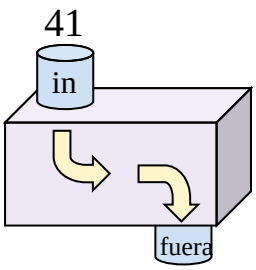

2)

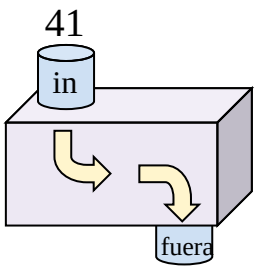

3)

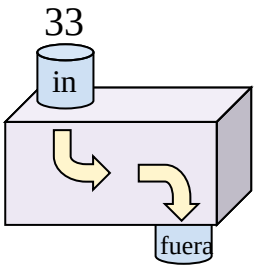

4)

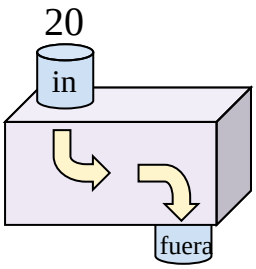

5)

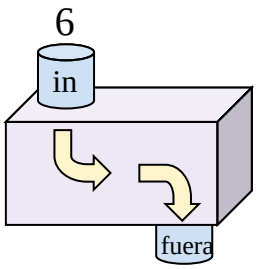

6)

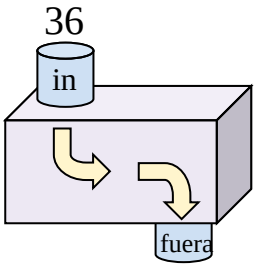

7)

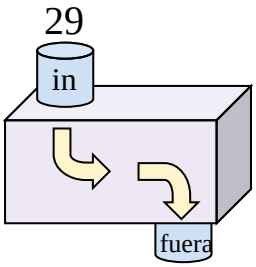

8)

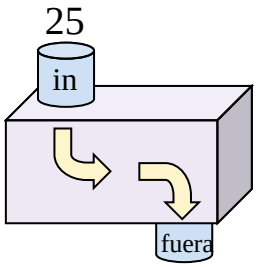

9)

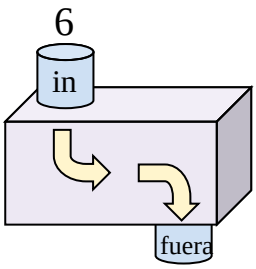

10)

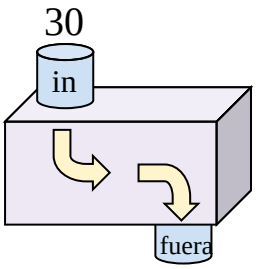

11)

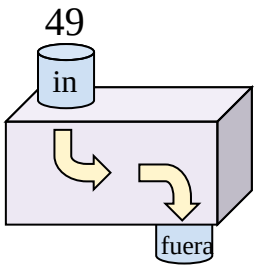

Respuestas

Ej. Agregar 20

1. _____
2. _____
3. _____
4. _____
5. _____
6. _____
7. _____
8. _____
9. _____
10. _____
11. _____

1-10	91	82	73	64	55	45	36	27	18	9
11	0									

Determina la regla que cada máquina de función está usando.

Ej)

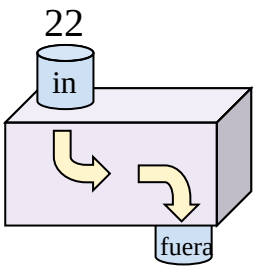

Agregar 20

1)

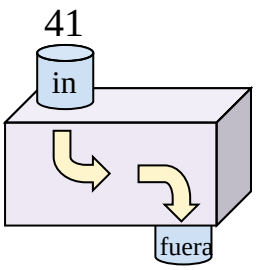

Restar 18

2)

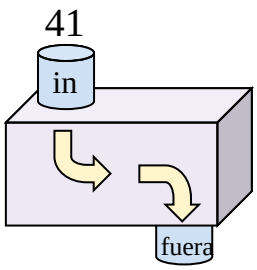

Restar 33

3)

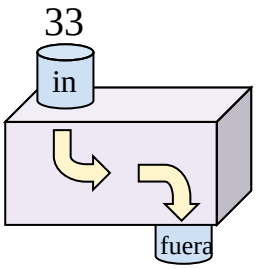

Restar 16

4)

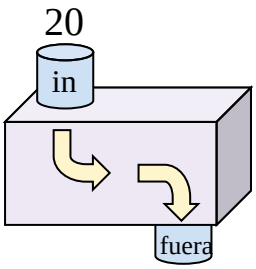

Restar 8

5)

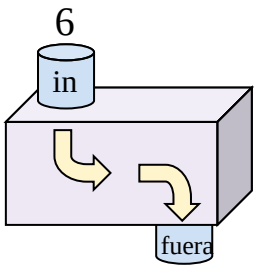

Agregar 37

6)

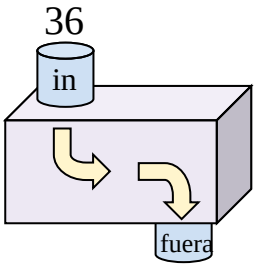

Restar 11

7)

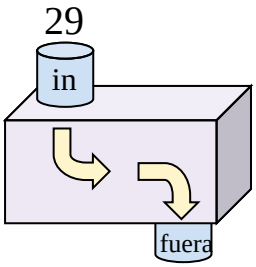

Agregar 15

8)

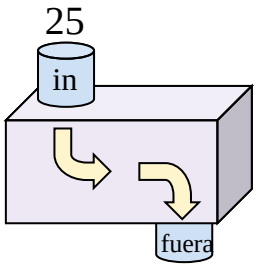

Agregar 25

9)

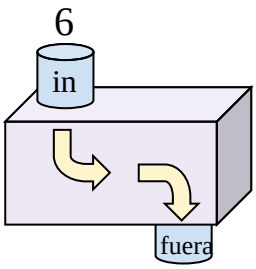

Agregar 10

10)

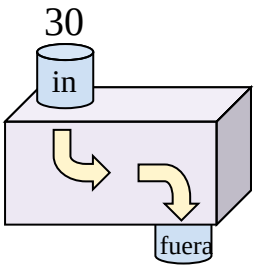

Restar 16

11)

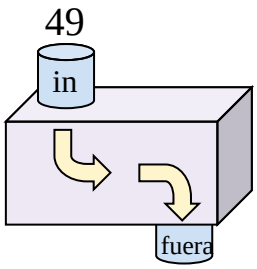

Restar 29

Respuestas

Ej. **Agregar 20**

1. **Restar 18**
2. **Restar 33**
3. **Restar 16**
4. **Restar 8**
5. **Agregar 37**
6. **Restar 11**
7. **Agregar 15**
8. **Agregar 25**
9. **Agregar 10**
10. **Restar 16**
11. **Restar 29**

1-10	91	82	73	64	55	45	36	27	18	9
11	0									

Determina la regla que cada máquina de función está usando.

Ej)

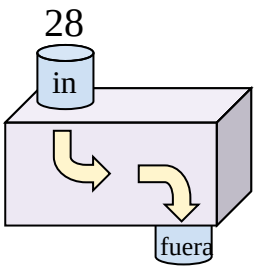

Agregar 8

1)

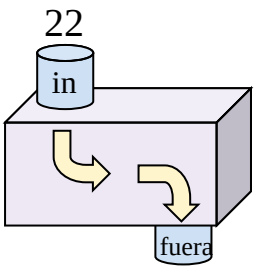

2)

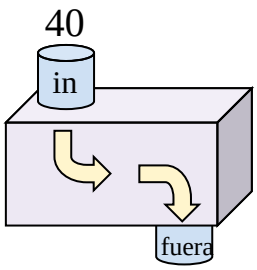

3)

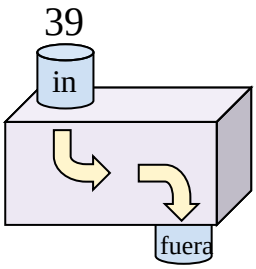

4)

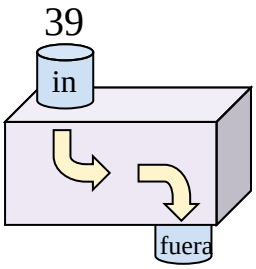

5)

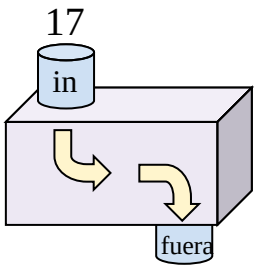

6)

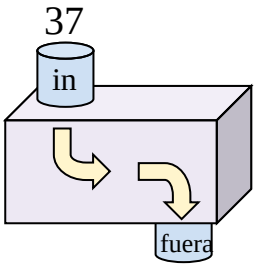

7)

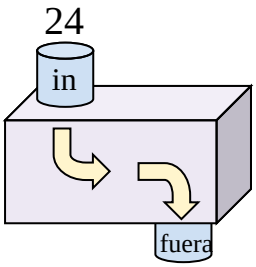

8)

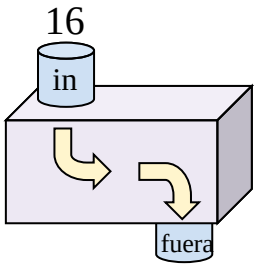

9)

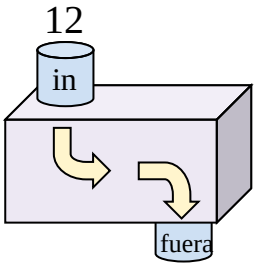

10)

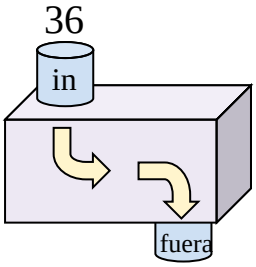

11)

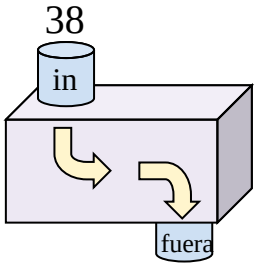

Respuestas

Ej. Agregar 8

1. _____
2. _____
3. _____
4. _____
5. _____
6. _____
7. _____
8. _____
9. _____
10. _____
11. _____

1-10	91	82	73	64	55	45	36	27	18	9
11	0									

Determina la regla que cada máquina de función está usando.

Ej)

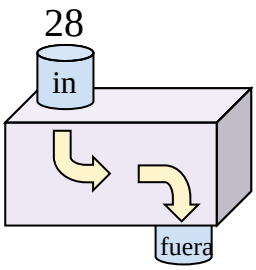

Agregar 8

1)

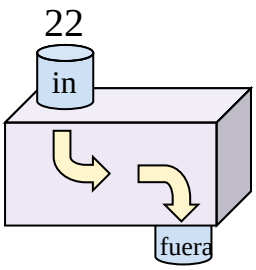

Agregar 6

2)

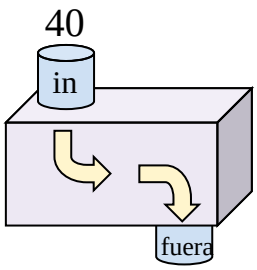

Restar 16

3)

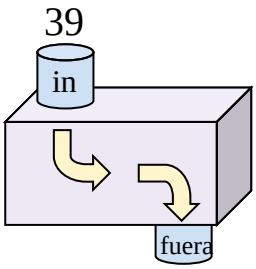

Restar 17

4)

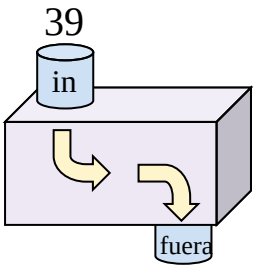

Restar 32

5)

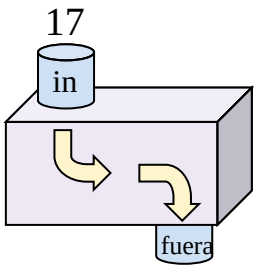

Restar 6

6)

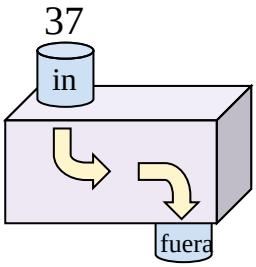

Restar 14

7)

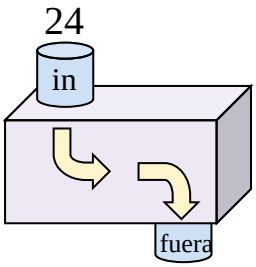

Agregar 18

8)

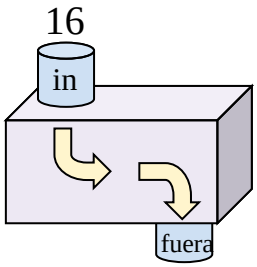

Agregar 33

9)

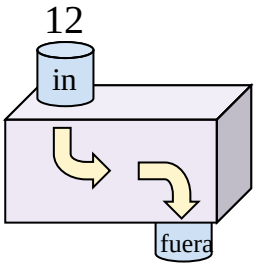

Agregar 34

10)

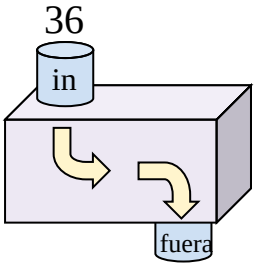

Restar 26

11)

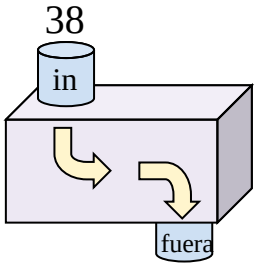

Restar 9

Respuestas

Ej.	Agregar 8
1.	Agregar 6
2.	Restar 16
3.	Restar 17
4.	Restar 32
5.	Restar 6
6.	Restar 14
7.	Agregar 18
8.	Agregar 33
9.	Agregar 34
10.	Restar 26
11.	Restar 9

1-10	91	82	73	64	55	45	36	27	18	9
11	0									

Máquinas de Funciones - (Sumar y Restar) Nombre:

Determina la regla que cada máquina de función está usando.

Ej)

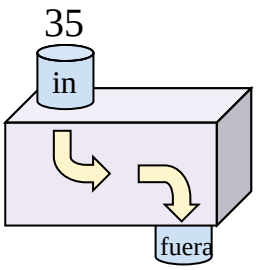

Restar 13

1)

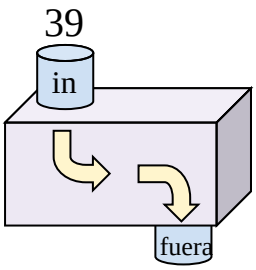

2)

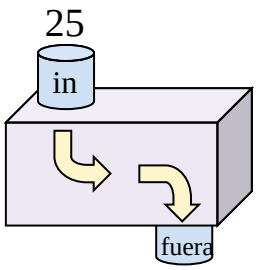

3)

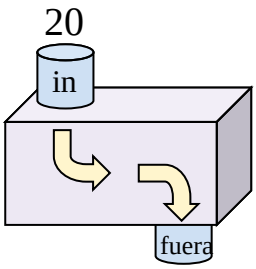

4)

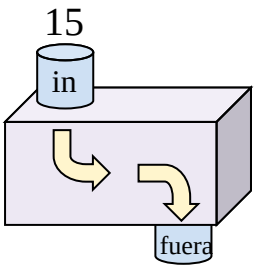

5)

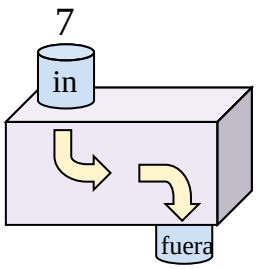

6)

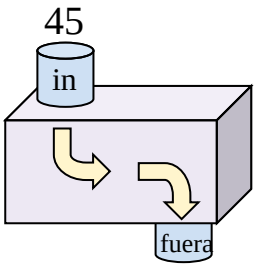

7)

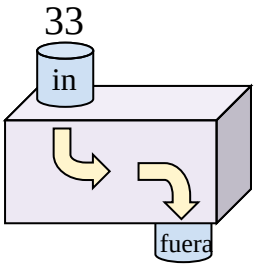

8)

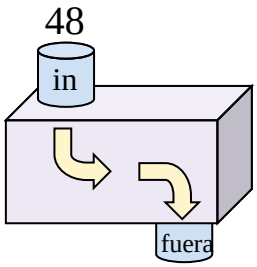

9)

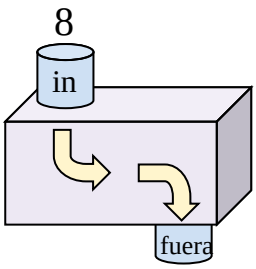

10)

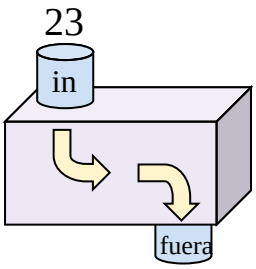

11)

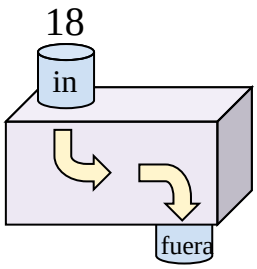

Respuestas

Ej. Restar 13

1. _____
2. _____
3. _____
4. _____
5. _____
6. _____
7. _____
8. _____
9. _____
10. _____
11. _____

1-10	91	82	73	64	55	45	36	27	18	9
11	0									

Determina la regla que cada máquina de función está usando.

Ej)

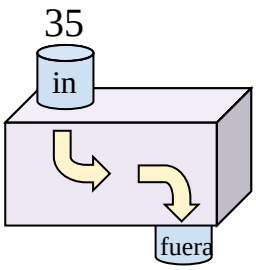

Restar 13

1)

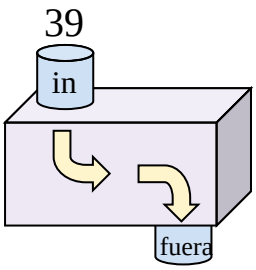

Restar 31

2)

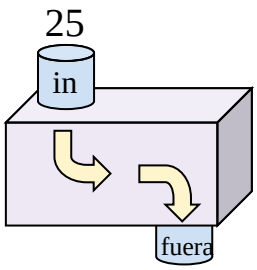

Agregar 10

3)

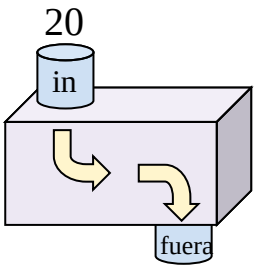

Agregar 8

4)

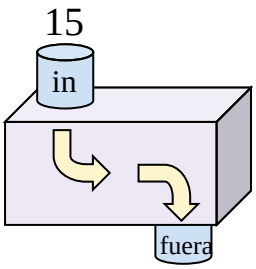

Agregar 34

5)

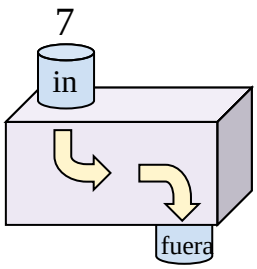

Agregar 21

6)

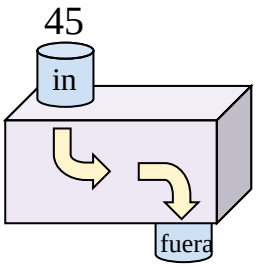

Restar 21

7)

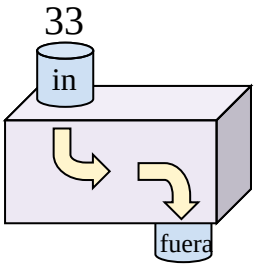

Restar 13

8)

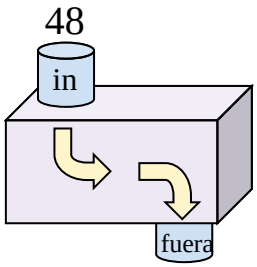

Restar 28

9)

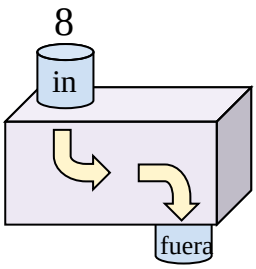

Agregar 38

10)

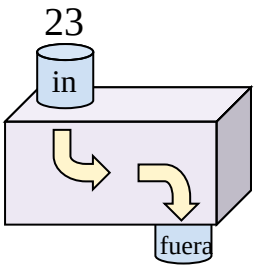

Agregar 12

11)

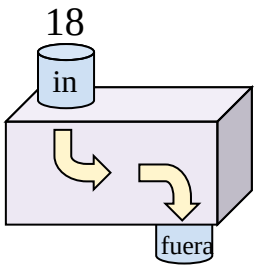

Agregar 6

Respuestas

Ej. **Restar 13**

1. **Restar 31**
2. **Agregar 10**
3. **Agregar 8**
4. **Agregar 34**
5. **Agregar 21**
6. **Restar 21**
7. **Restar 13**
8. **Restar 28**
9. **Agregar 38**
10. **Agregar 12**
11. **Agregar 6**

1-10	91	82	73	64	55	45	36	27	18	9
11	0									

Máquinas de Funciones - (Sumar y Restar) Nombre:

Determina la regla que cada máquina de función está usando.

Ej)

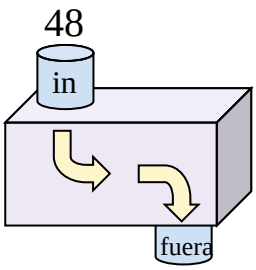

Restar 33

1)

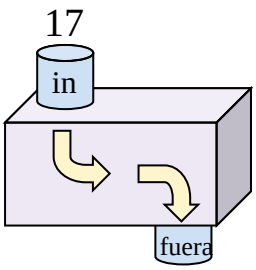

2)

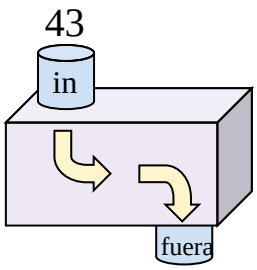

3)

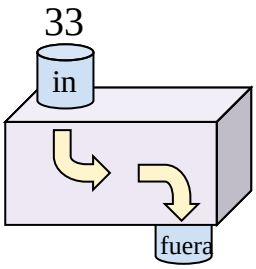

4)

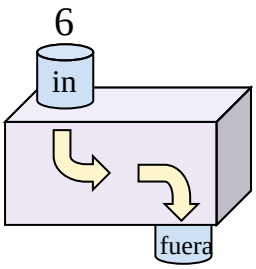

5)

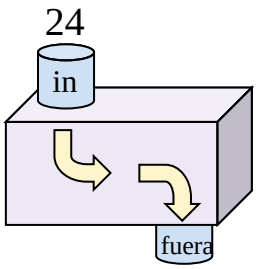

6)

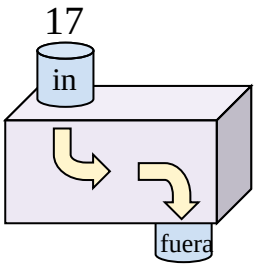

7)

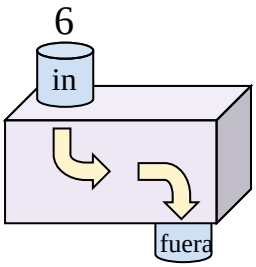

8)

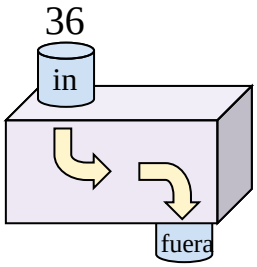

9)

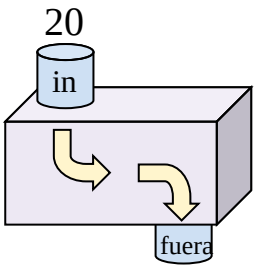

10)

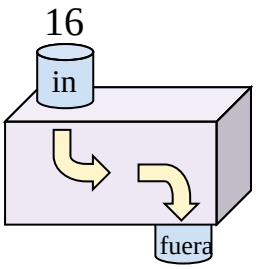

11)

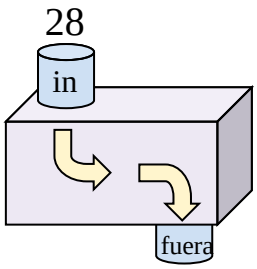

Respuestas

Ej. Restar 33

1. _____
2. _____
3. _____
4. _____
5. _____
6. _____
7. _____
8. _____
9. _____
10. _____
11. _____

1-10	91	82	73	64	55	45	36	27	18	9
11	0									

Determina la regla que cada máquina de función está usando.

Ej)

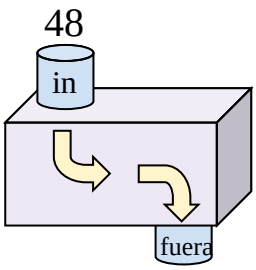

Restar 33

1)

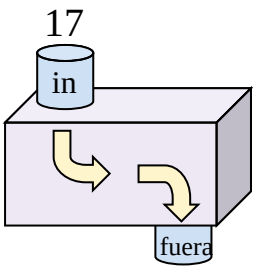

Agregar 15

2)

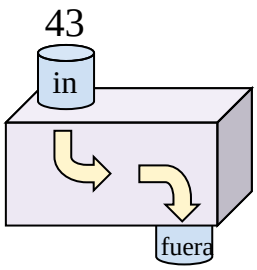

Restar 23

3)

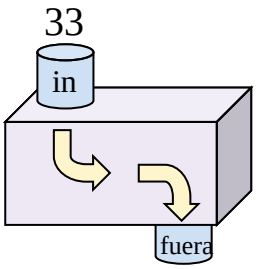

Restar 15

4)

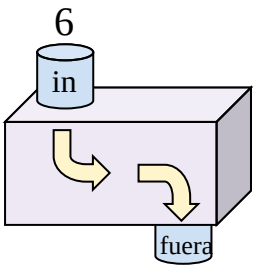

Agregar 36

5)

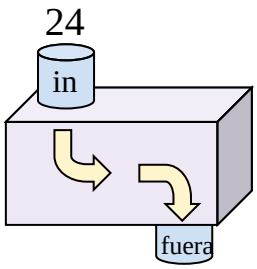

Agregar 14

6)

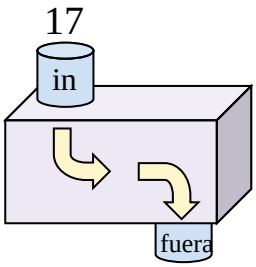

Agregar 9

7)

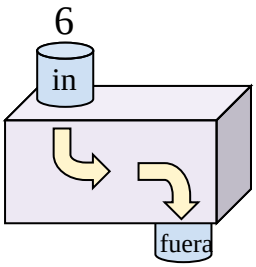

Agregar 14

8)

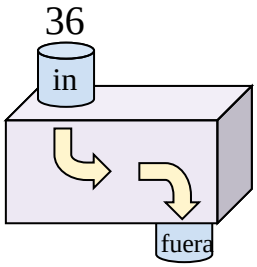

Restar 16

9)

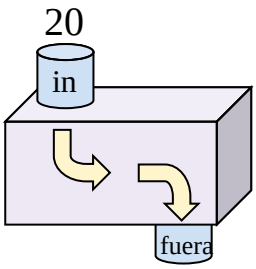

Agregar 8

10)

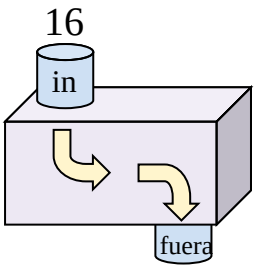

Agregar 19

11)

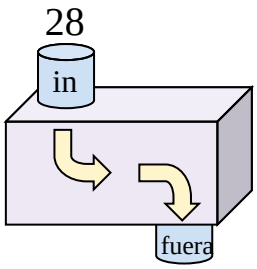

Restar 9

Respuestas

Ej. **Restar 33**

1. **Agregar 15**
2. **Restar 23**
3. **Restar 15**
4. **Agregar 36**
5. **Agregar 14**
6. **Agregar 9**
7. **Agregar 14**
8. **Restar 16**
9. **Agregar 8**
10. **Agregar 19**
11. **Restar 9**

1-10	91	82	73	64	55	45	36	27	18	9
11	0									

Determina la regla que cada máquina de función está usando.

Ej)

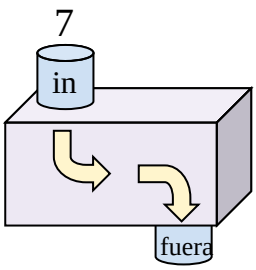

Agregar 13

1)

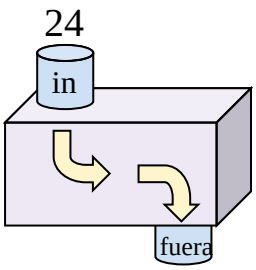

2)

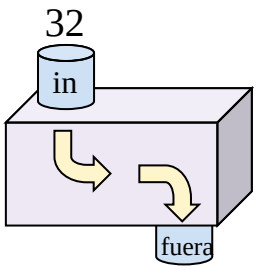

3)

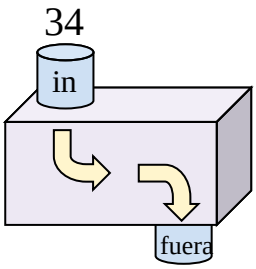

4)

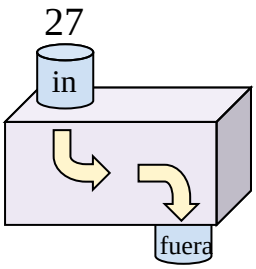

5)

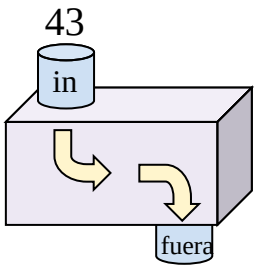

6)

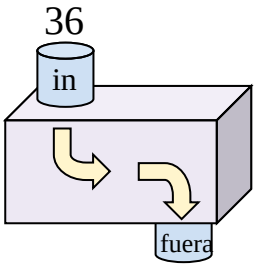

7)

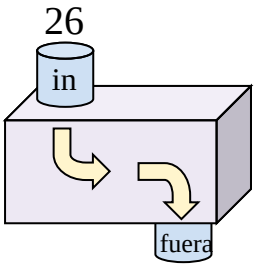

8)

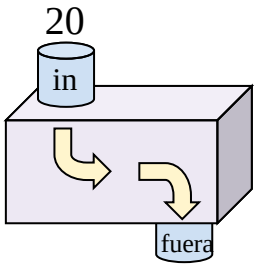

9)

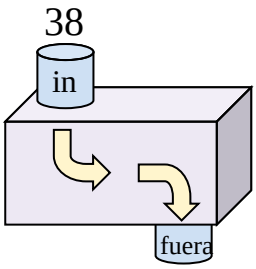

10)

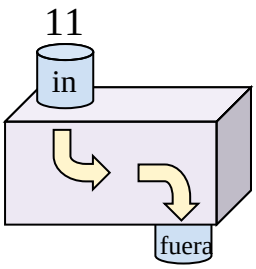

11)

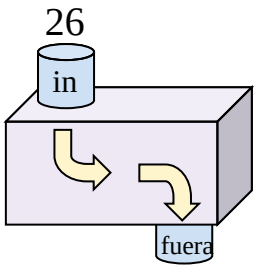

Respuestas

Ej. Agregar 13

1. _____
2. _____
3. _____
4. _____
5. _____
6. _____
7. _____
8. _____
9. _____
10. _____
11. _____

1-10	91	82	73	64	55	45	36	27	18	9
11	0									

Determina la regla que cada máquina de función está usando.

Ej)

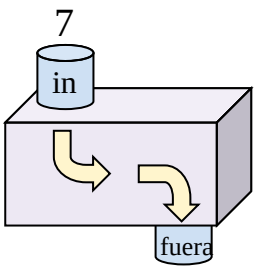

Agregar 13

1)

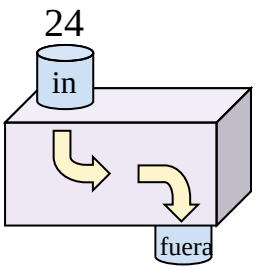

Agregar 9

2)

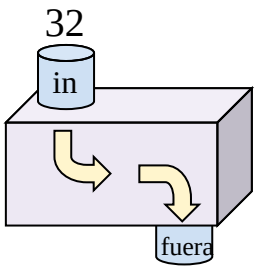

Restar 23

3)

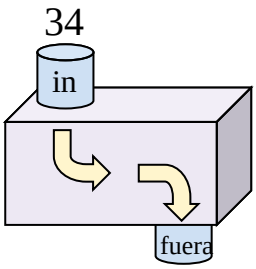

Restar 5

4)

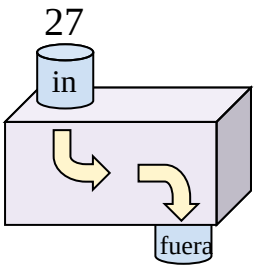

Agregar 10

5)

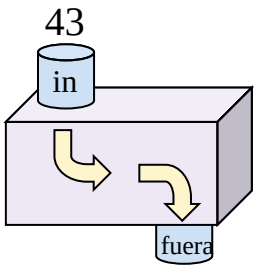

Restar 17

6)

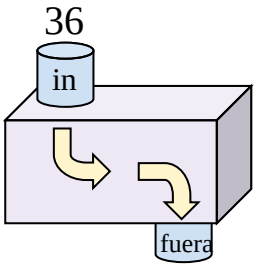

Restar 16

7)

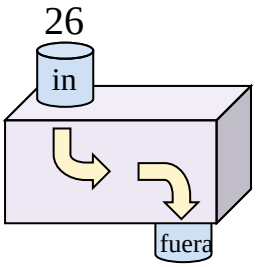

Agregar 5

8)

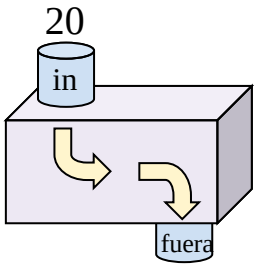

Agregar 13

9)

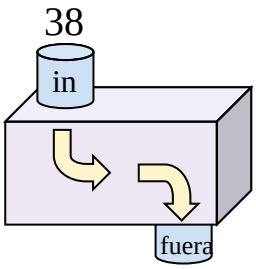

Restar 26

10)

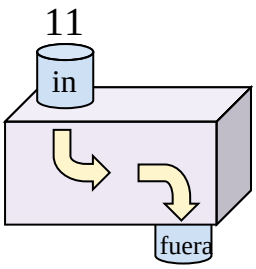

Agregar 8

11)

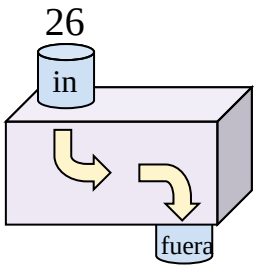

Restar 16

Respuestas

Ej. **Agregar 13**

1. **Agregar 9**
2. **Restar 23**
3. **Restar 5**
4. **Agregar 10**
5. **Restar 17**
6. **Restar 16**
7. **Agregar 5**
8. **Agregar 13**
9. **Restar 26**
10. **Agregar 8**
11. **Restar 16**

1-10	91	82	73	64	55	45	36	27	18	9
11	0									

Máquinas de Funciones - (Sumar y Restar) Nombre:

Determina la regla que cada máquina de función está usando.

Ej)

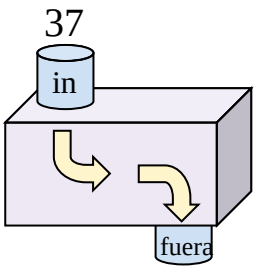

Restar 14

1)

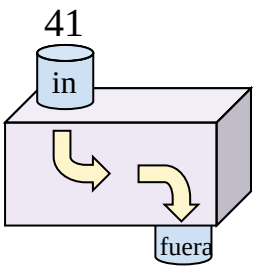

2)

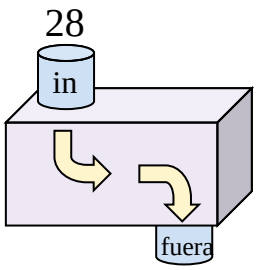

3)

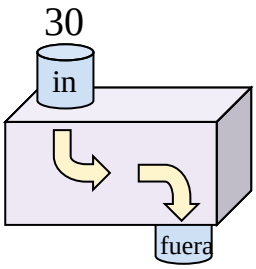

4)

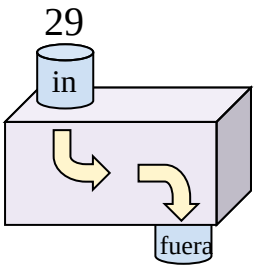

5)

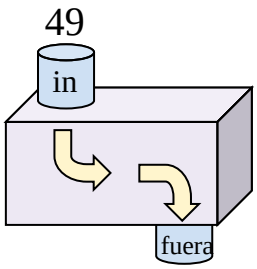

6)

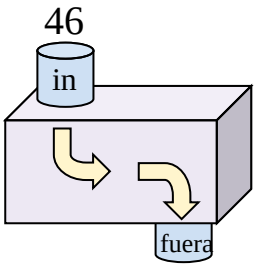

7)

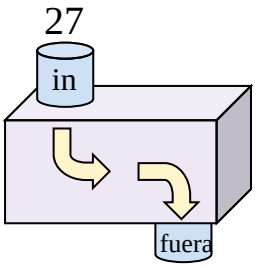

8)

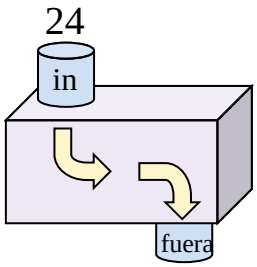

9)

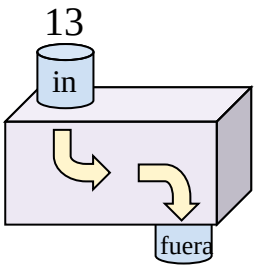

10)

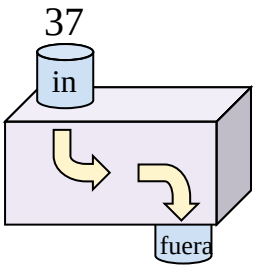

11)

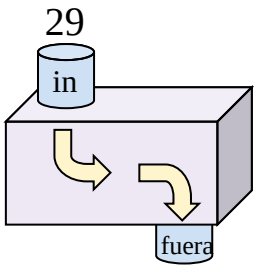

Respuestas

Ej. Restar 14

1. _____
2. _____
3. _____
4. _____
5. _____
6. _____
7. _____
8. _____
9. _____
10. _____
11. _____

1-10	91	82	73	64	55	45	36	27	18	9
11	0									

Determina la regla que cada máquina de función está usando.

Ej)

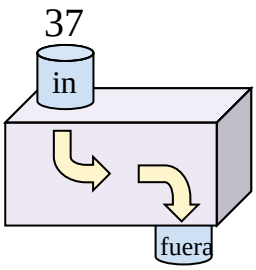

Restar 14

1)

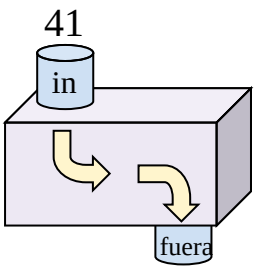

Restar 19

2)

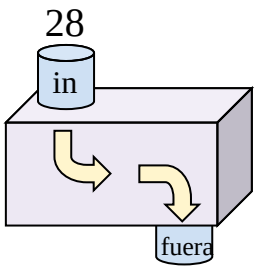

Agregar 16

3)

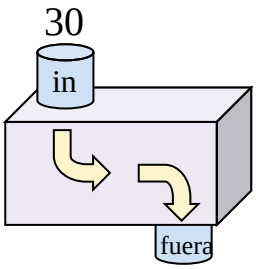

Agregar 14

4)

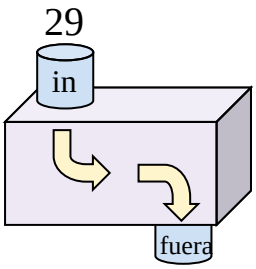

Agregar 21

5)

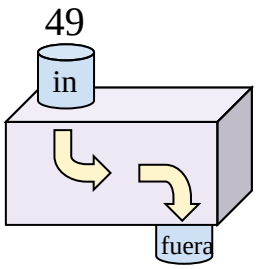

Restar 33

6)

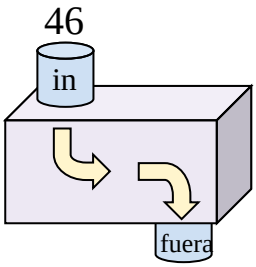

Restar 29

7)

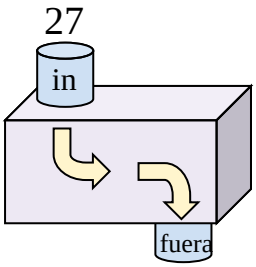

Agregar 9

8)

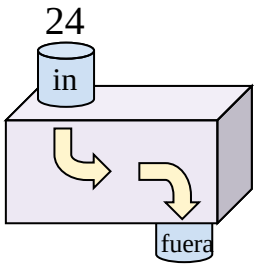

Agregar 6

9)

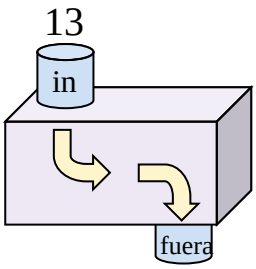

Agregar 12

10)

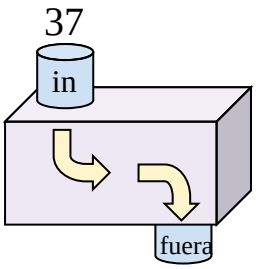

Restar 7

11)

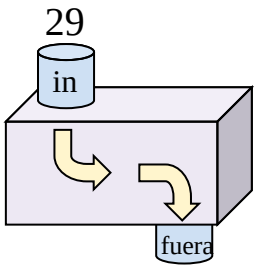

Agregar 16

Respuestas

Ej. **Restar 14**

1. **Restar 19**
2. **Agregar 16**
3. **Agregar 14**
4. **Agregar 21**
5. **Restar 33**
6. **Restar 29**
7. **Agregar 9**
8. **Agregar 6**
9. **Agregar 12**
10. **Restar 7**
11. **Agregar 16**

1-10	91	82	73	64	55	45	36	27	18	9
11	0									

Máquinas de Funciones - (Sumar y Restar) Nombre:

Determina la regla que cada máquina de función está usando.

Ej)

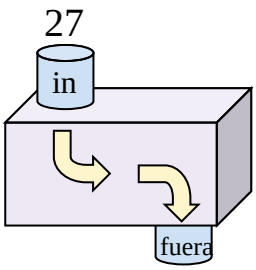

Agregar 12

1)

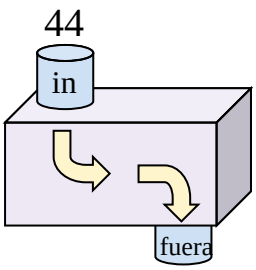

2)

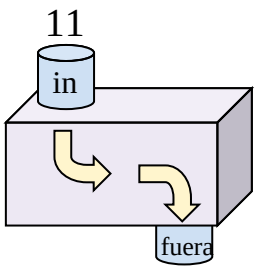

3)

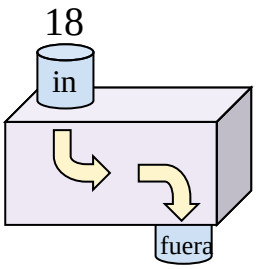

4)

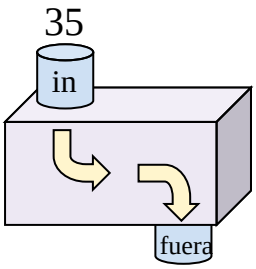

5)

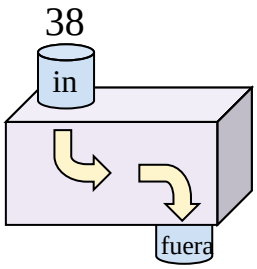

6)

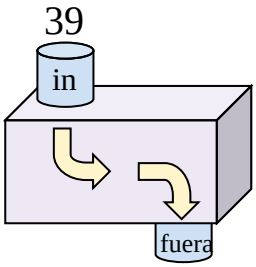

7)

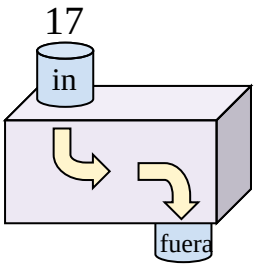

8)

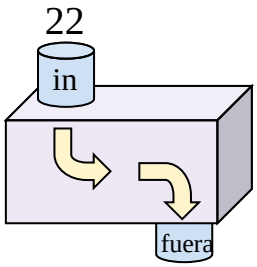

9)

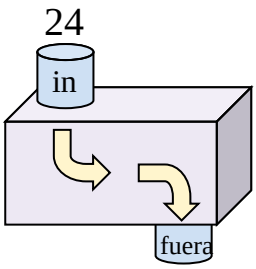

10)

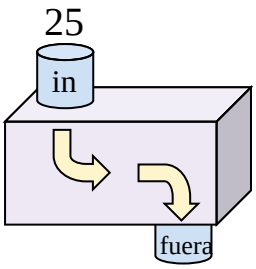

11)

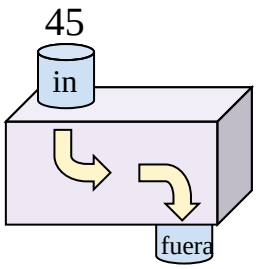

Respuestas

Ej. **Agregar 12**

1. _____
2. _____
3. _____
4. _____
5. _____
6. _____
7. _____
8. _____
9. _____
10. _____
11. _____

1-10	91	82	73	64	55	45	36	27	18	9
11	0									

Determina la regla que cada máquina de función está usando.

Ej)

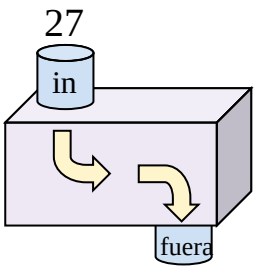

Agregar 12

1)

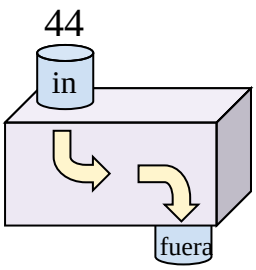

Restar 30

2)

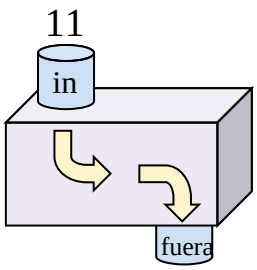

Agregar 8

3)

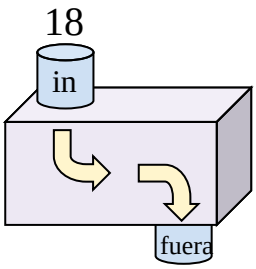

Agregar 30

4)

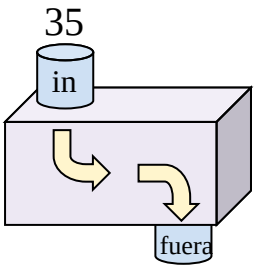

Restar 26

5)

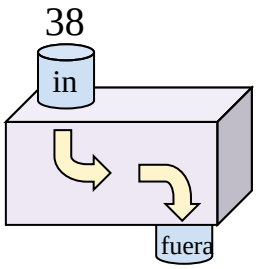

Restar 22

6)

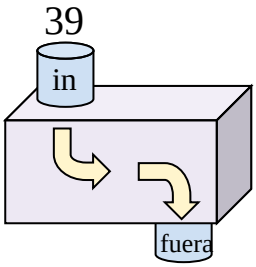

Restar 21

7)

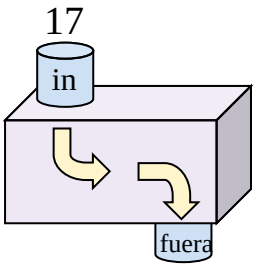

Agregar 18

8)

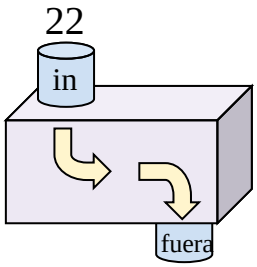

Restar 5

9)

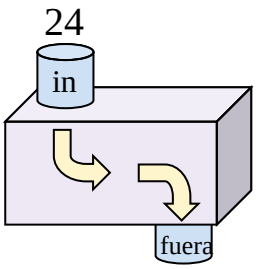

Agregar 12

10)

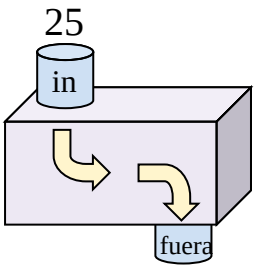

Agregar 18

11)

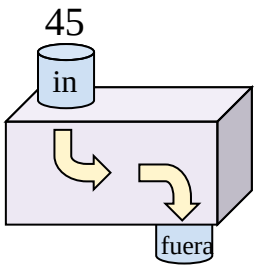

Restar 35

Respuestas

Ej. **Agregar 12**

1. **Restar 30**
2. **Agregar 8**
3. **Agregar 30**
4. **Restar 26**
5. **Restar 22**
6. **Restar 21**
7. **Agregar 18**
8. **Restar 5**
9. **Agregar 12**
10. **Agregar 18**
11. **Restar 35**

1-10	91	82	73	64	55	45	36	27	18	9
11	0									

Máquinas de Funciones - (Sumar y Restar) Nombre:

Determina la regla que cada máquina de función está usando.

Ej)

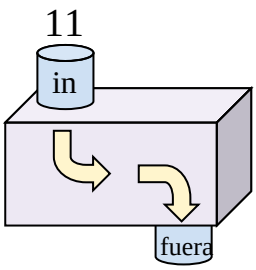

Agregar 20

1)

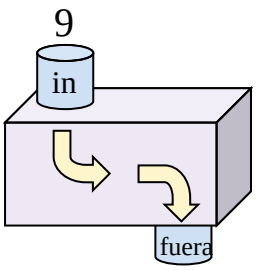

2)

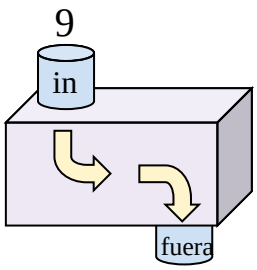

3)

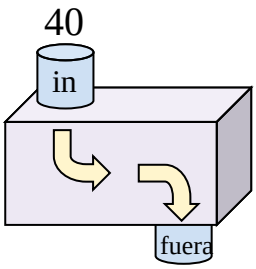

4)

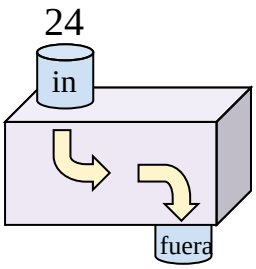

5)

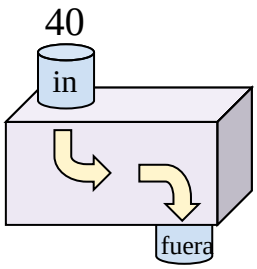

6)

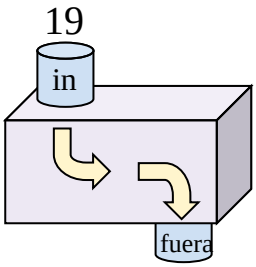

7)

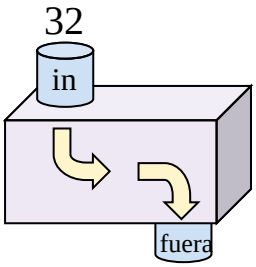

8)

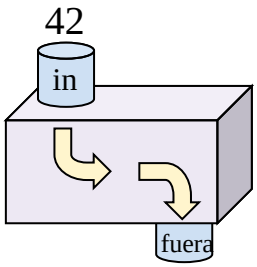

9)

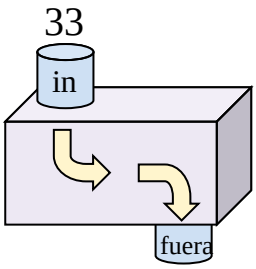

10)

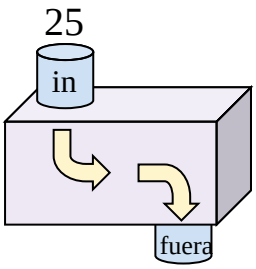

11)

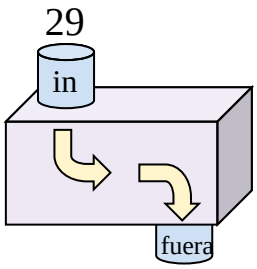

Respuestas

Ej. Agregar 20

1. _____
2. _____
3. _____
4. _____
5. _____
6. _____
7. _____
8. _____
9. _____
10. _____
11. _____

1-10	91	82	73	64	55	45	36	27	18	9
11	0									

Determina la regla que cada máquina de función está usando.

Ej)

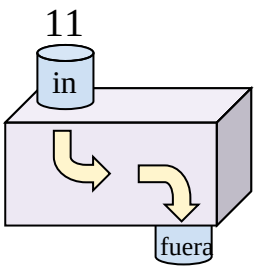

Agregar 20

1)

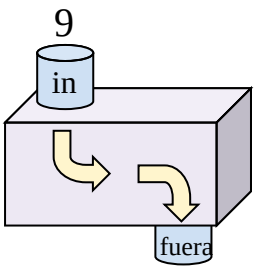

Agregar 27

2)

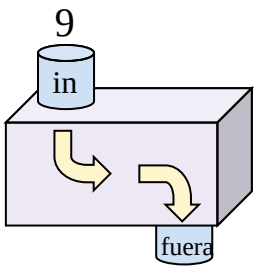

Agregar 25

3)

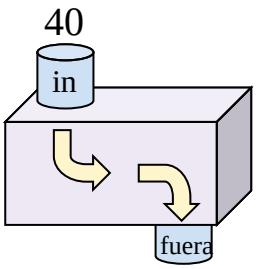

Restar 28

4)

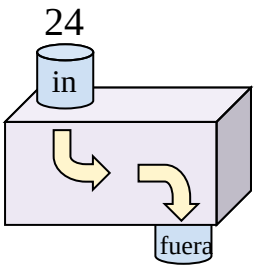

Restar 6

5)

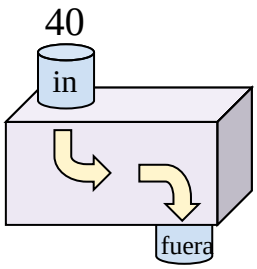

Restar 34

6)

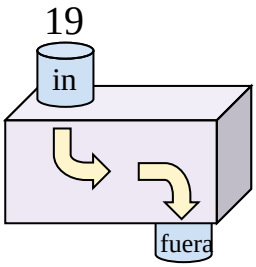

Agregar 14

7)

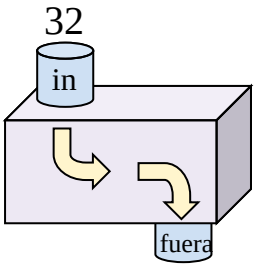

Restar 8

8)

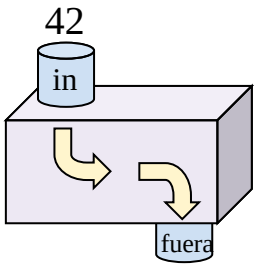

Restar 24

9)

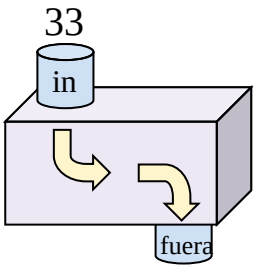

Restar 25

10)

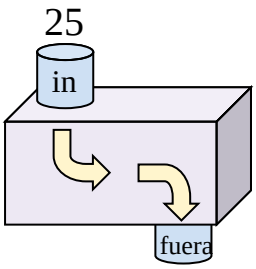

Agregar 14

11)

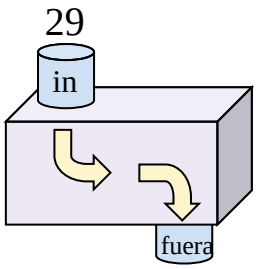

Agregar 9

Respuestas

Ej. **Agregar 20**

1. **Agregar 27**
2. **Agregar 25**
3. **Restar 28**
4. **Restar 6**
5. **Restar 34**
6. **Agregar 14**
7. **Restar 8**
8. **Restar 24**
9. **Restar 25**
10. **Agregar 14**
11. **Agregar 9**

1-10	91	82	73	64	55	45	36	27	18	9
11	0									