Máquinas de Funciones - (Sumar y Restar) Nombre:

Determina la regla que cada máquina de función está usando.

Ej)

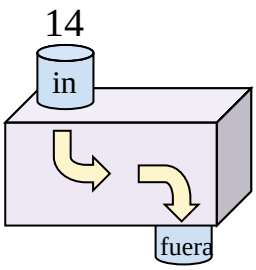

Agregar 20

1)

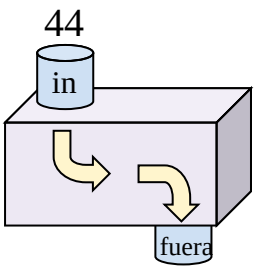

2)

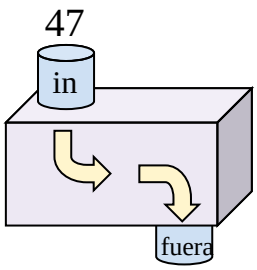

3)

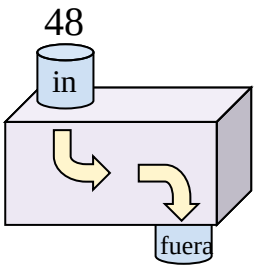

4)

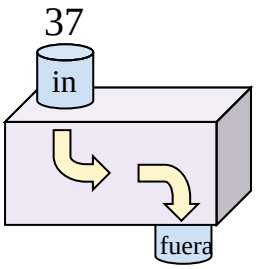

5)

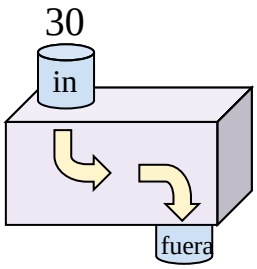

6)

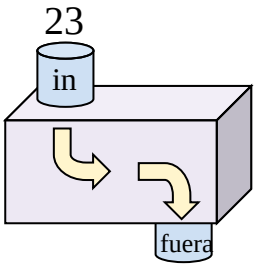

7)

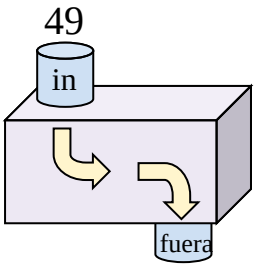

8)

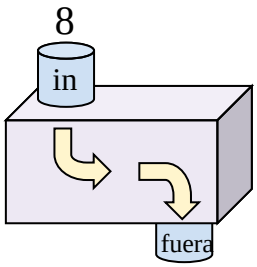

9)

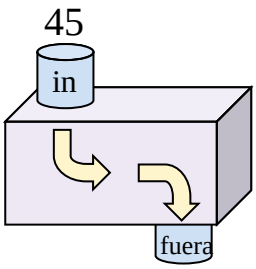

10)

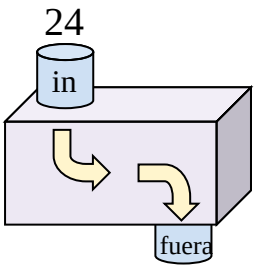

11)

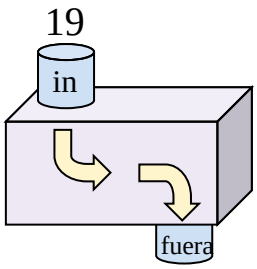

Respuestas

Ej. Agregar 20

1. _____
2. _____
3. _____
4. _____
5. _____
6. _____
7. _____
8. _____
9. _____
10. _____
11. _____

Máquinas de Funciones - (Sumar y Restar) Nombre: **Clave De Respuestas**

Determina la regla que cada máquina de función está usando.

Ej)

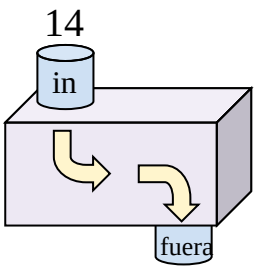

Agregar 20

1)

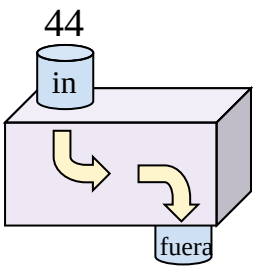

Restar 34

2)

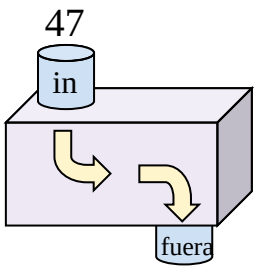

Restar 29

3)

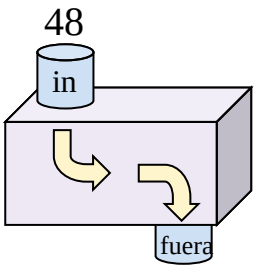

Restar 37

4)

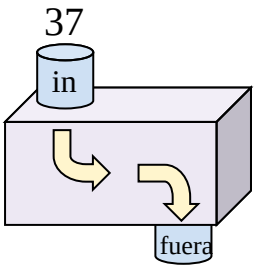

Restar 11

5)

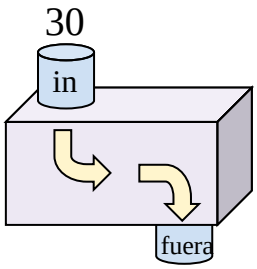

Restar 5

6)

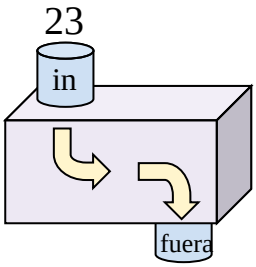

Agregar 7

7)

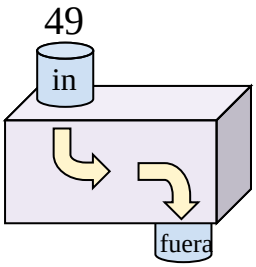

Restar 26

8)

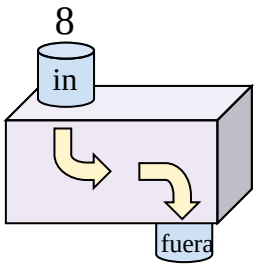

Agregar 9

9)

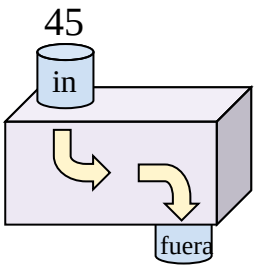

Restar 20

10)

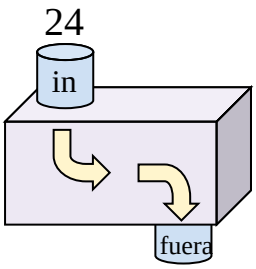

Agregar 24

11)

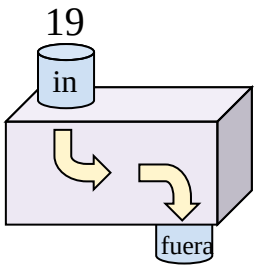

Agregar 7

Respuestas

Ej. **Agregar 20**

1. **Restar 34**
2. **Restar 29**
3. **Restar 37**
4. **Restar 11**
5. **Restar 5**
6. **Agregar 7**
7. **Restar 26**
8. **Agregar 9**
9. **Restar 20**
10. **Agregar 24**
11. **Agregar 7**