Dibuje la manecilla de las horas y los minutos en el reloj para que represente la hora mostrada.

1) 10:20

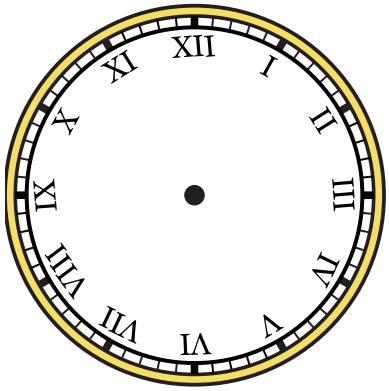

2) 1:45

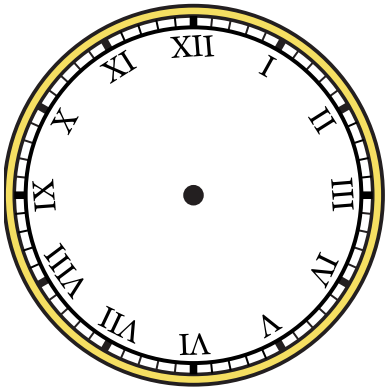

3) 6:35

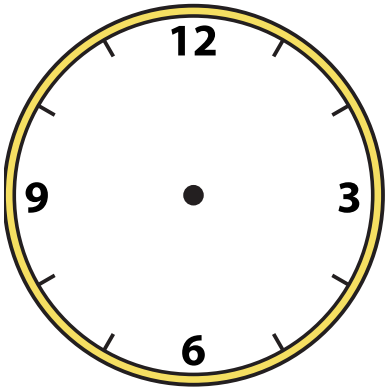

4) 5:25



5) 7:45



6) 10:10

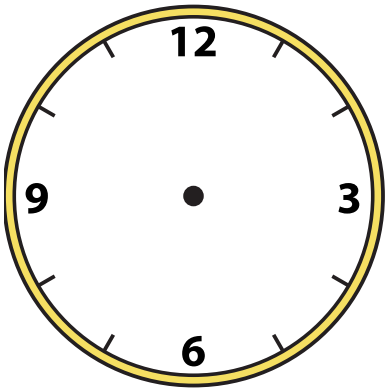

7) 10:25



8) 12:50

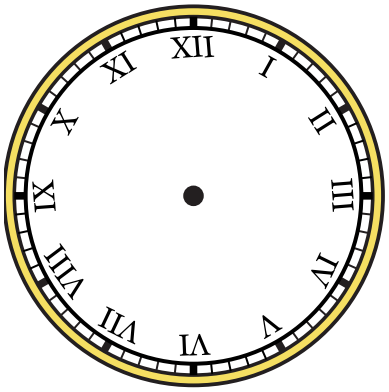

9) 9:10

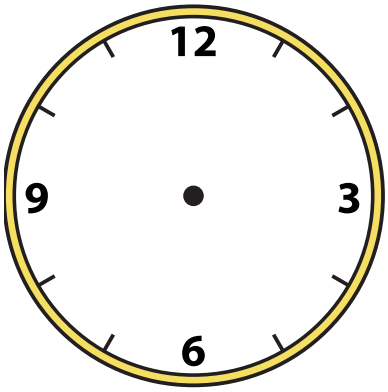

1-9	89	78	67	56	44	33	22	11	0

Dibuje la manecilla de las horas y los minutos en el reloj para que represente la hora mostrada.

1) 10:20



2) 1:45



3) 6:35



4) 5:25

5) 7:45

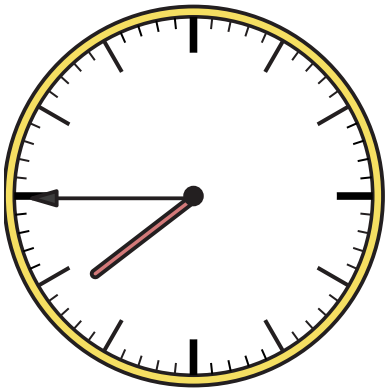

6) 10:10



7) 10:25



8) 12:50



9) 9:10



1-9	89	78	67	56	44	33	22	11	0