Lectura de un reloj analógico

Nombre:

**Determine la hora que se muestra en el reloj.**

1) 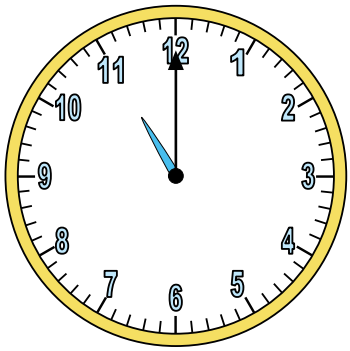

2) 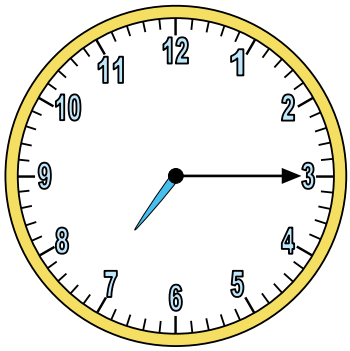

3) 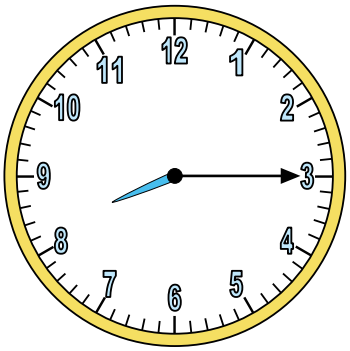

4) 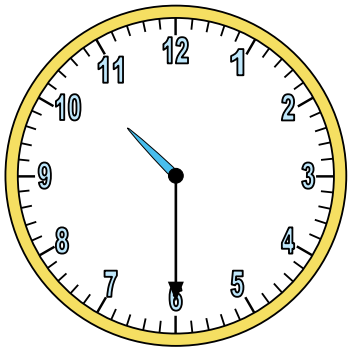

5) 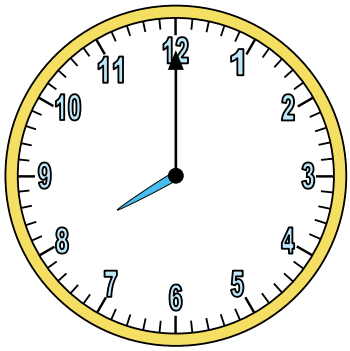

6) 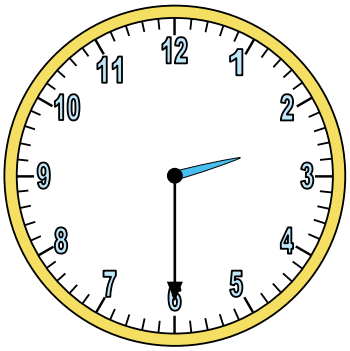

7) 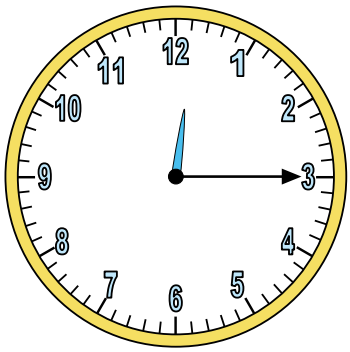

8) 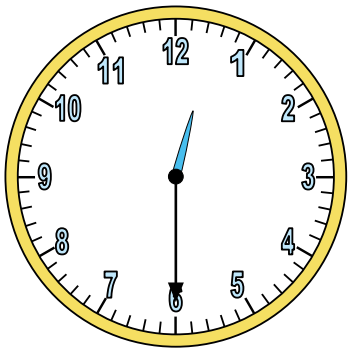

9) 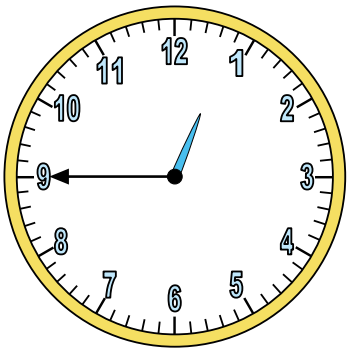

10) 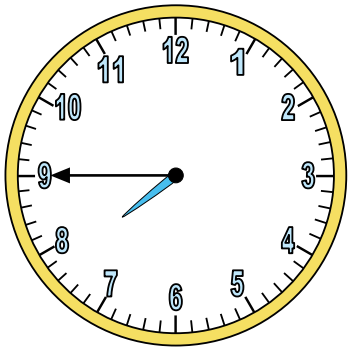

11) 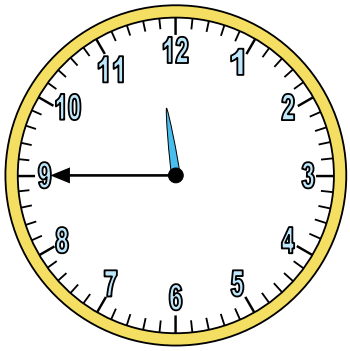

12) 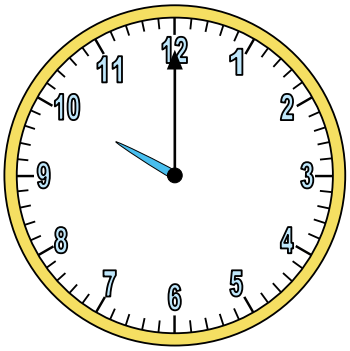

**Respuestas**

1. _____
2. _____
3. _____
4. _____
5. _____
6. _____
7. _____
8. _____
9. _____
10. _____
11. _____
12. _____



| | | | | | | | | | | |
|---|---|---|---|---|---|---|---|---|---|---|
| 1-10 | 92 | 83 | 75 | 67 | 58 | 50 | 42 | 33 | 25 | 17 |
| 11-12 | 8 | 0 | | | | | | | | |

Nombre: **Clave De Respuestas**

**Determine la hora que se muestra en el reloj.**

1) 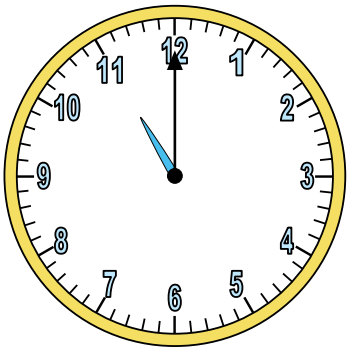

2) 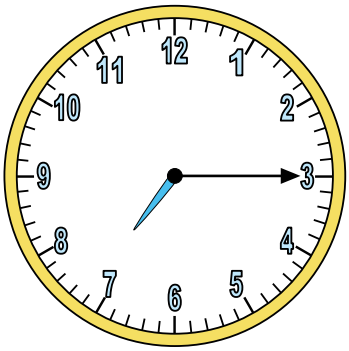

3) 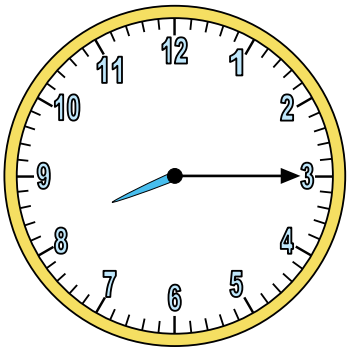

4) 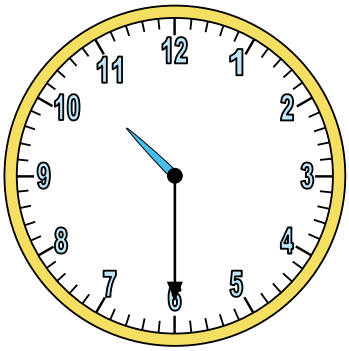

5) 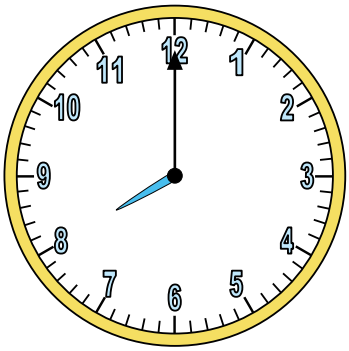

6) 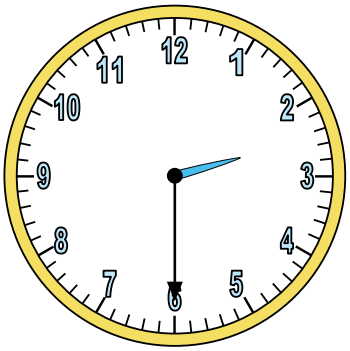

7) 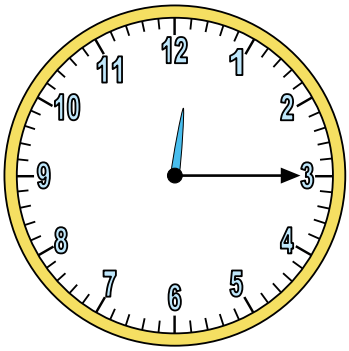

8) 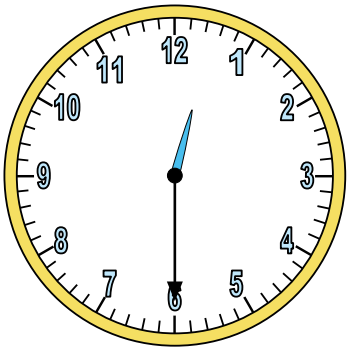

9) 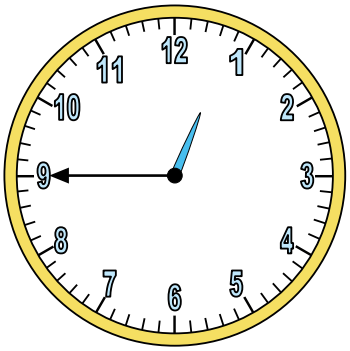

10) 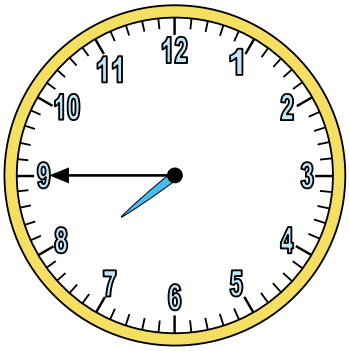

11) 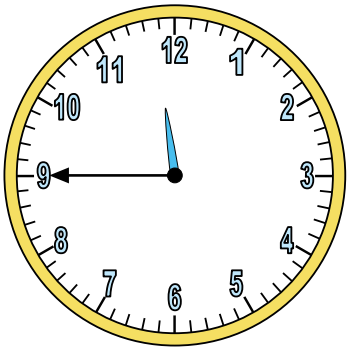

12) 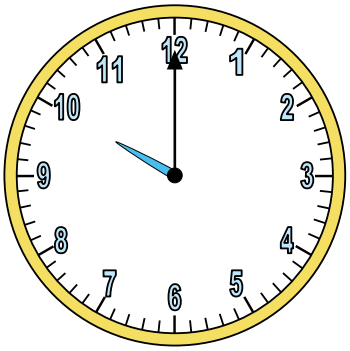

## Respuestas

1. **11:00**
2. **7:15**
3. **8:15**
4. **10:30**
5. **8:00**
6. **2:30**
7. **12:15**
8. **12:30**
9. **12:45**
10. **7:45**
11. **11:45**
12. **10:00**



| | | | | | | | | | | |
|---|---|---|---|---|---|---|---|---|---|---|
| 1-10 | 92 | 83 | 75 | 67 | 58 | 50 | 42 | 33 | 25 | 17 |
| 11-12 | 8 | 0 | | | | | | | | |