Contando figuras Nombre:

Cuenta el número de figuras en cada caja.



Ej) = 6

1) = _____

2) = _____

3) = _____



4) = _____

5) = _____

6) = _____

7) = _____

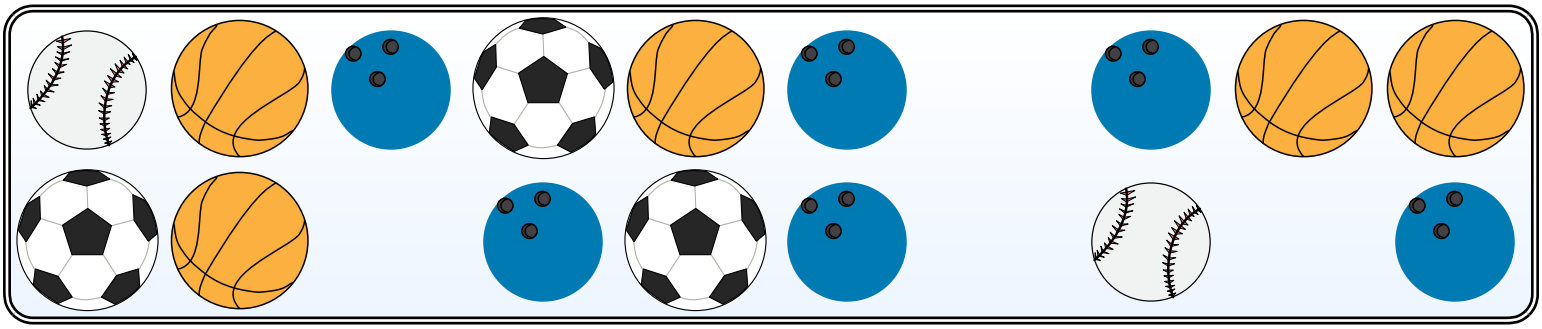

8) = _____

9) = _____

10) = _____

11) = _____

1-10	91	82	73	64	55	45	36	27	18	9
11	0									

Contando figuras

Nombre: **Clave De Respuestas**

Cuenta el número de figuras en cada caja.



Ej) = 6

1) = 3

2) = 5

3) = 3



4) = 4

5) = 6

6) = 5

7) = 5

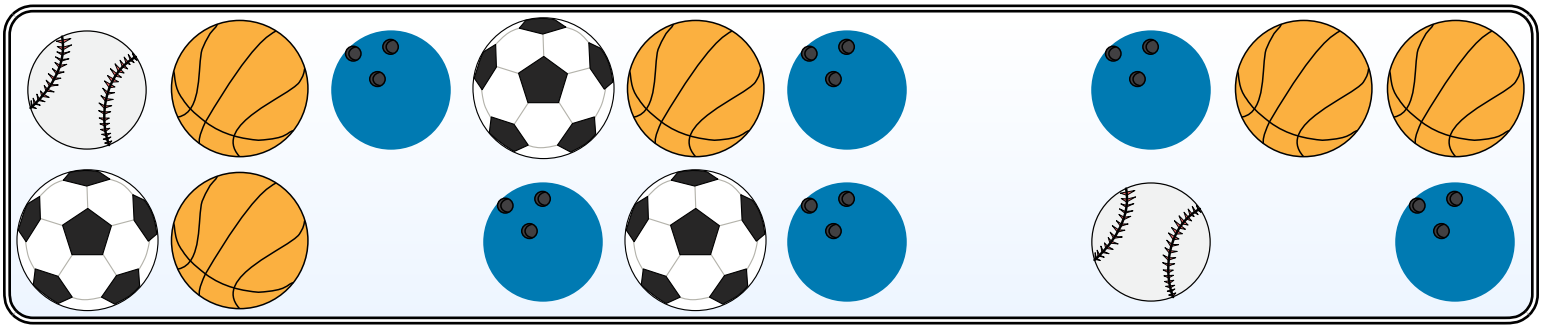

8) = 2

9) = 5

10) = 6

11) = 3

1-10	91	82	73	64	55	45	36	27	18	9
11	0									