Determinación del valor con bloques

Nombre:

Encontrar el valor que cada conjunto de bloques representa.

1)

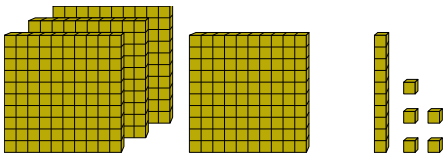

2)

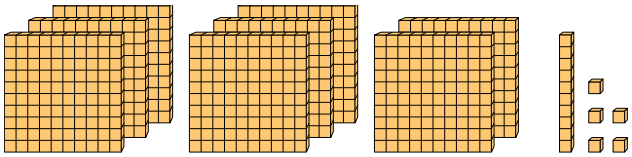

3)

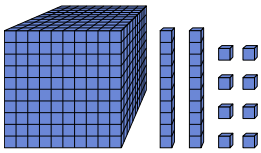

4)

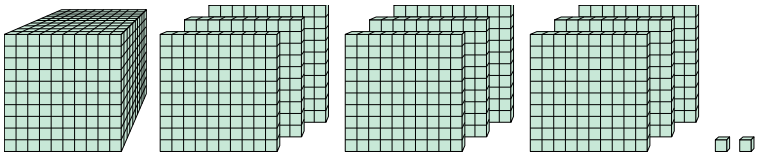

5)

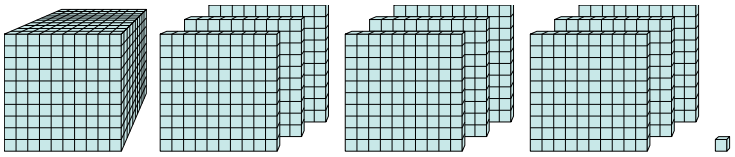

6)

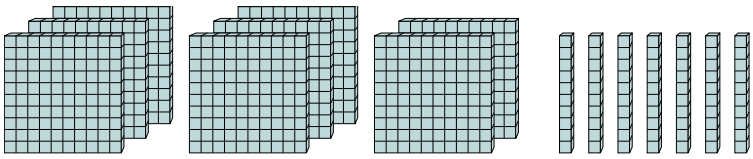

7)

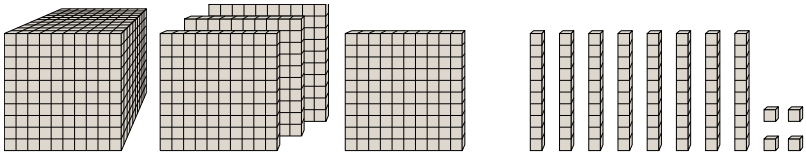

8)

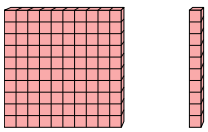

9)

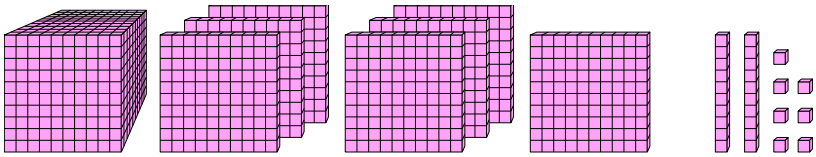

10)

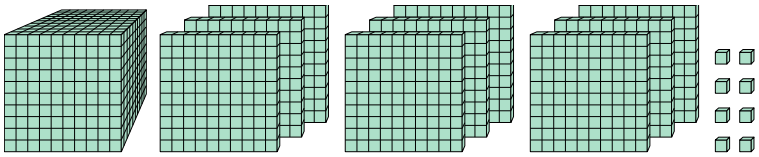

Respuestas

1. _____
2. _____
3. _____
4. _____
5. _____
6. _____
7. _____
8. _____
9. _____
10. _____

1-10	90	80	70	60	50	40	30	20	10	0

Determinación del valor con bloques

Nombre: **Clave De Respuestas**

Encontrar el valor que cada conjunto de bloques representa.

1)

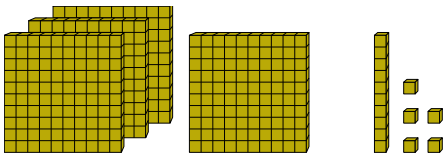

2)

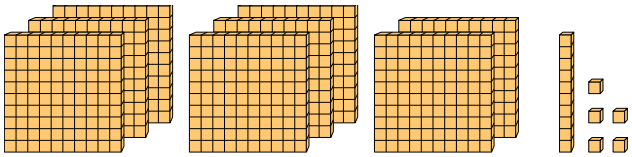

3)

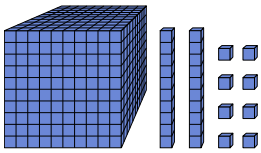

4)

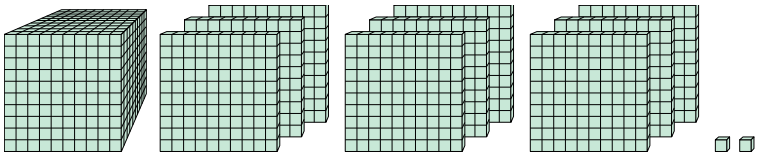

5)

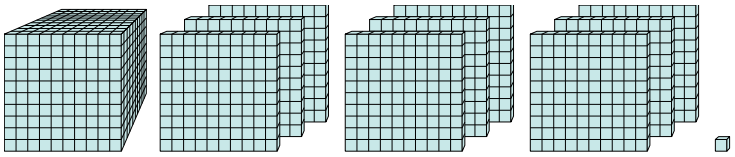

6)

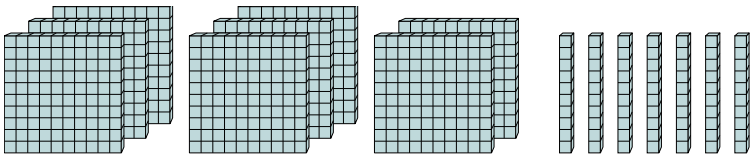

7)

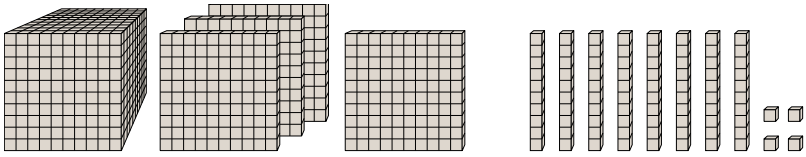

8)

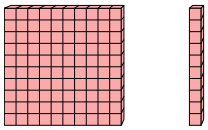

9)

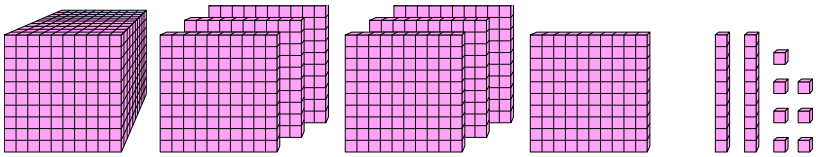

10)

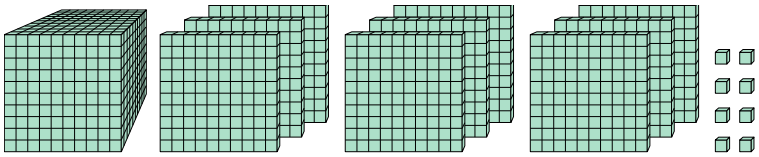

Respuestas

1. **415**
2. **815**
3. **1,028**
4. **1,902**
5. **1,901**
6. **870**
7. **1,484**
8. **110**
9. **1,727**
10. **1,908**

1-10	90	80	70	60	50	40	30	20	10	0