Encontrar pares o impares (visual) Nombre:

Determinar si el número de figuras en la caja es par o impar.

1)

2)

3)

4)

5) 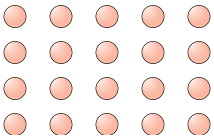

6) 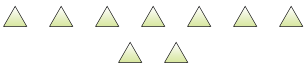

7) 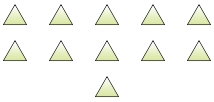

8)

9) 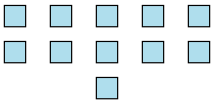

10)

Respuestas

1. _____
2. _____
3. _____
4. _____
5. _____
6. _____
7. _____
8. _____
9. _____
10. _____

1-10	90	80	70	60	50	40	30	20	10	0

Encontrar pares o impares (visual) Nombre: **Clave De Respuestas**

Determinar si el número de figuras en la caja es par o impar.

1)

7

2)

18

3)

6

4)

7

5) 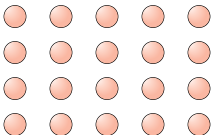

20

6) 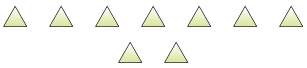

9

7) 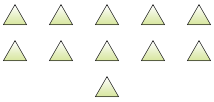

11

8)

5

9) 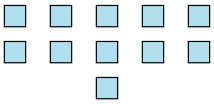

11

10)

6

Respuestas

1. Impar
2. Par
3. Par
4. Impar
5. Par
6. Impar
7. Impar
8. Impar
9. Impar
10. Par

1-10	90	80	70	60	50	40	30	20	10	0