Llenando Rectas Numéricas Nombre:

Llenar los espacios vaciós en la recta numérica. Cada recta numérica se incrementa de a 1.

1)

2)



3)



4)

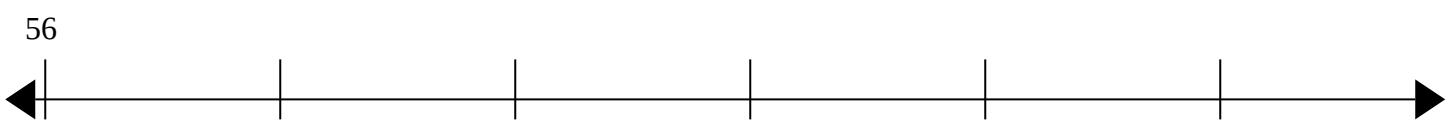

5)



6)



7)

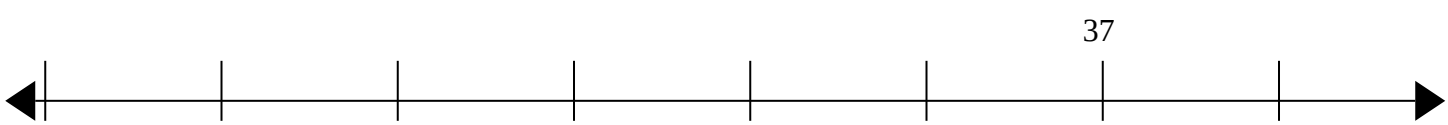

8)

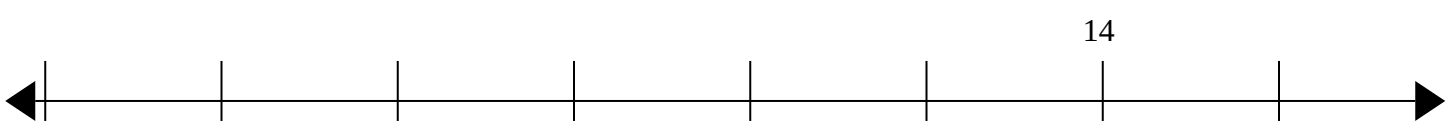

9)

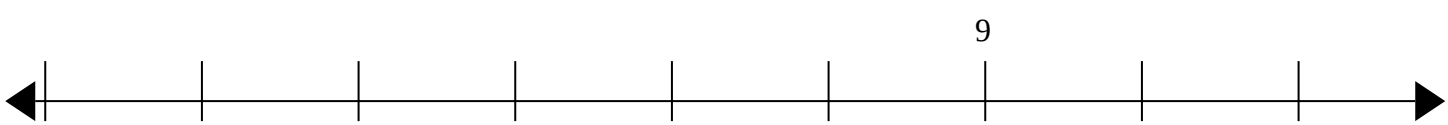

10)



1-10	90	80	70	60	50	40	30	20	10	0

Llenando Rectas Numéricas

Nombre: **Clave De Respuestas**

Llenar los espacios vaciós en la recta numérica. Cada recta numérica se incrementa de a 1.

1) 18 19 20 21 22 23 24 25

2) 60 61 62 63 64

3) 33 34 35 36 37

4) 56 57 58 59 60 61

5) 49 50 51 52 53

6) 31 32 33 34 35 36 37

7) 31 32 33 34 35 36 37 38

8) 8 9 10 11 12 13 14 15

9) 3 4 5 6 7 8 9 10 11

10) 20 21 22 23 24

1-10	90	80	70	60	50	40	30	20	10	0