Dividiendo con una recta numérica

Nombre:

Usa las rectas numéricas para resolver los problemas.

1) 20 ÷ 4 =

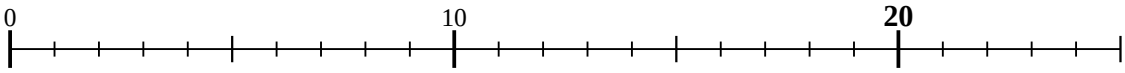

2) 15 ÷ 3 =

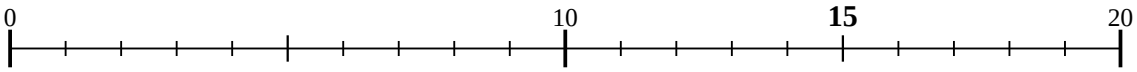

3) 24 ÷ 6 =

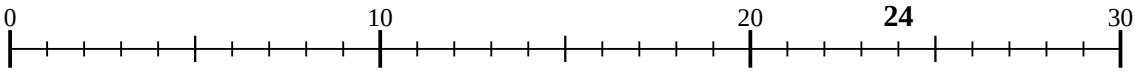

4) 8 ÷ 2 =

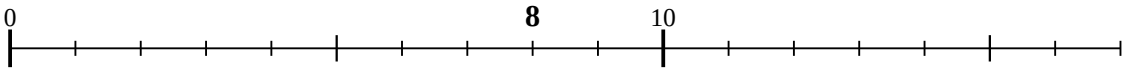

5) 12 ÷ 6 =

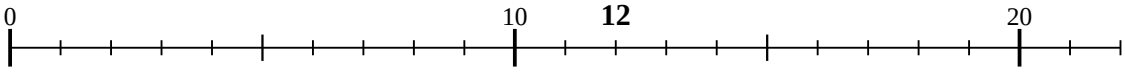

6) 40 ÷ 10 =

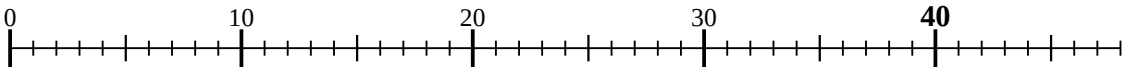

7) 18 ÷ 6 =

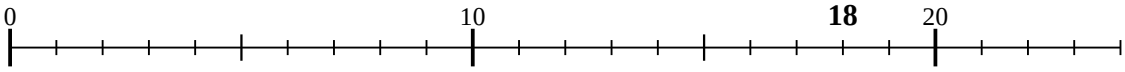

8) 4 ÷ 2 =

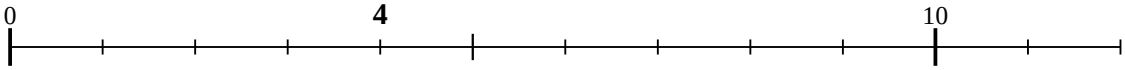

9) 35 ÷ 7 =

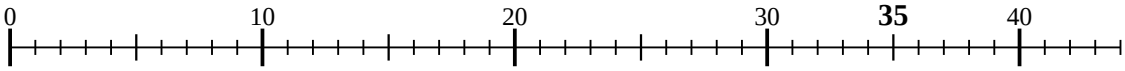

10) 14 ÷ 7 =

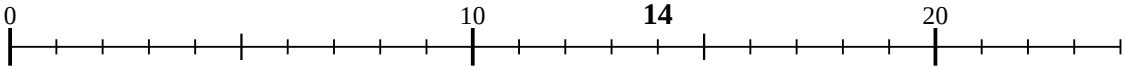

11) 10 ÷ 5 =

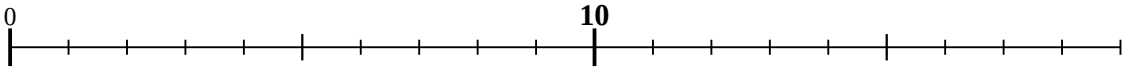

Respuestas

1. _____
2. _____
3. _____
4. _____
5. _____
6. _____
7. _____
8. _____
9. _____
10. _____
11. _____

1-10	91	82	73	64	55	45	36	27	18	9
11	0									

Dividiendo con una recta numérica

Nombre: **Clave De Respuestas**

Usa las rectas numéricas para resolver los problemas.

1) 20 ÷ 4 =

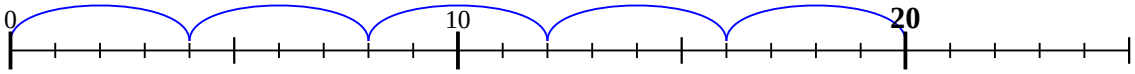

2) 15 ÷ 3 =

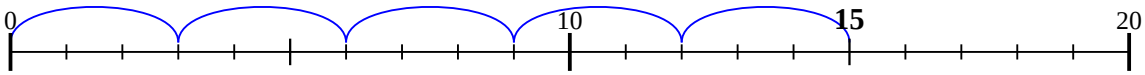

3) 24 ÷ 6 =

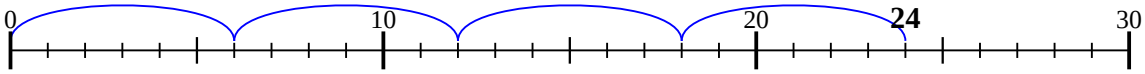

4) 8 ÷ 2 =

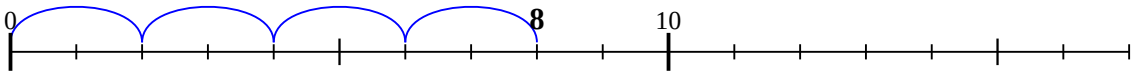

5) 12 ÷ 6 =

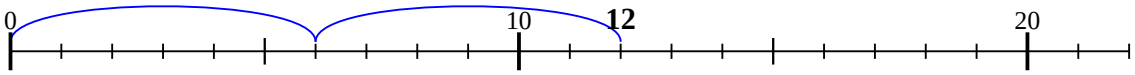

6) 40 ÷ 10 =

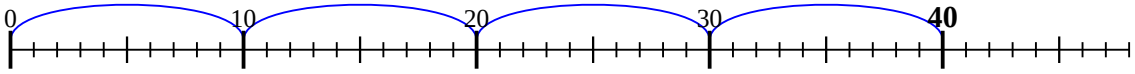

7) 18 ÷ 6 =

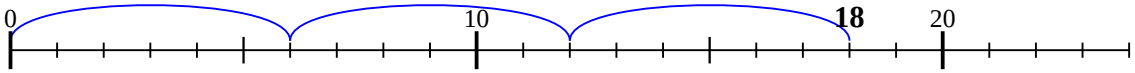

8) 4 ÷ 2 =

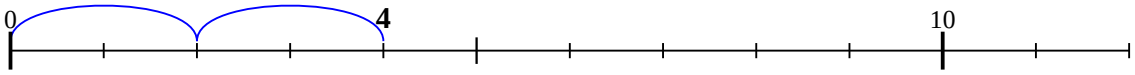

9) 35 ÷ 7 =

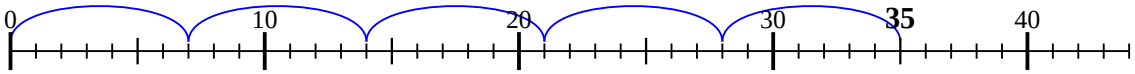

10) 14 ÷ 7 =

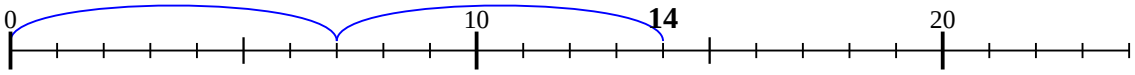

11) 10 ÷ 5 =

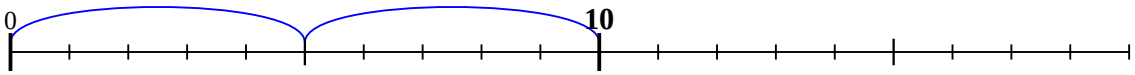

Respuestas

1. 5
2. 5
3. 4
4. 4
5. 2
6. 4
7. 3
8. 2
9. 5
10. 2
11. 2