Multiplicando con una Recta Numérica

Nombre:

Usar la recta numérica para resolver cada problema.

1) 4 × 9 =
9 × 4 =

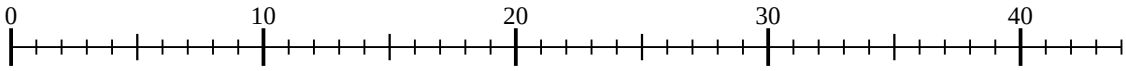

2) 4 × 3 =
3 × 4 =

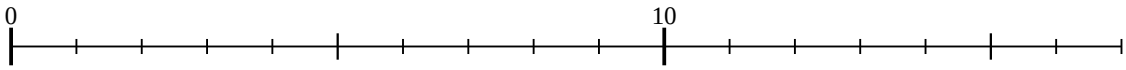

3) 3 × 6 =
6 × 3 =

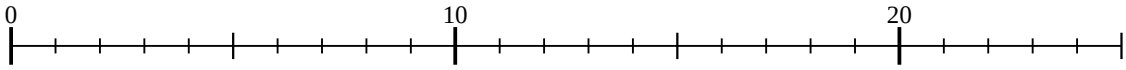

4) 4 × 5 =
5 × 4 =

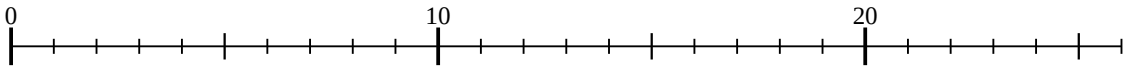

5) 3 × 4 =
4 × 3 =

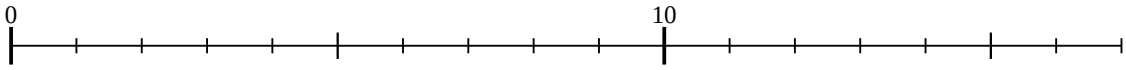

6) 5 × 2 =
2 × 5 =

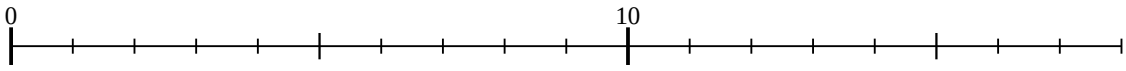

7) 3 × 8 =
8 × 3 =

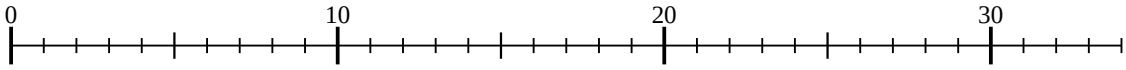

8) 3 × 2 =
2 × 3 =

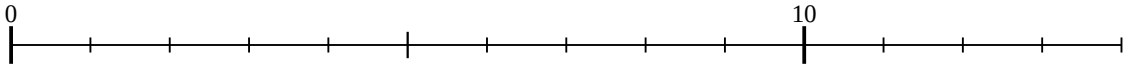

9) 2 × 6 =
6 × 2 =

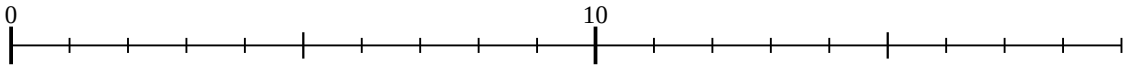

10) 2 × 2 =
2 × 2 =

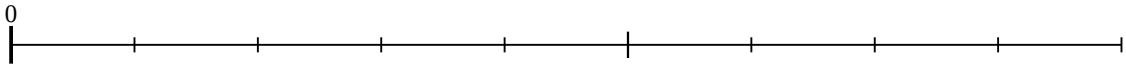

11) 3 × 5 =
5 × 3 =

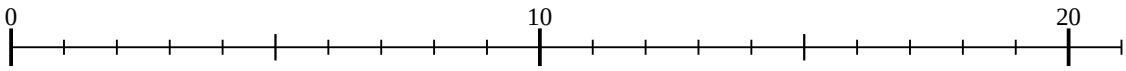

Respuestas

1. _____
2. _____
3. _____
4. _____
5. _____
6. _____
7. _____
8. _____
9. _____
10. _____
11. _____

Multiplicando con una Recta Numérica

Nombre: **Clave De Respuestas**

Usar la recta numérica para resolver cada problema.

1) 4 × 9 =
9 × 4 =

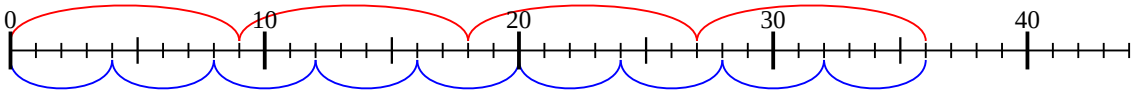

2) 4 × 3 =
3 × 4 =

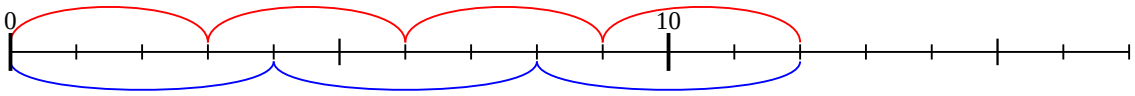

3) 3 × 6 =
6 × 3 =

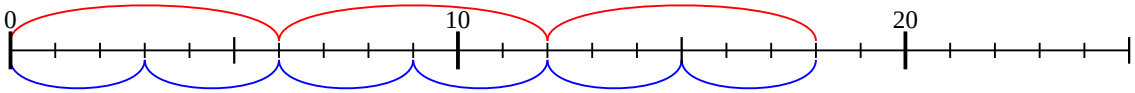

4) 4 × 5 =
5 × 4 =

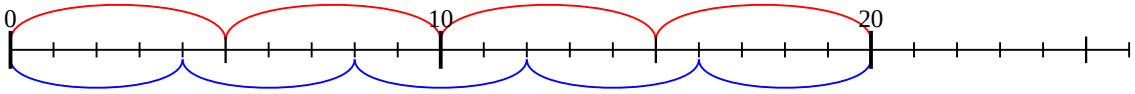

5) 3 × 4 =
4 × 3 =

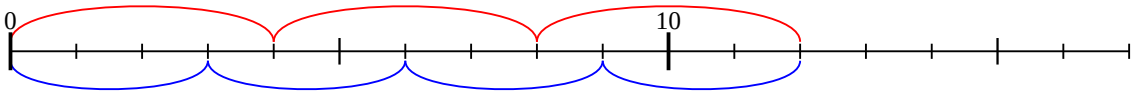

6) 5 × 2 =
2 × 5 =

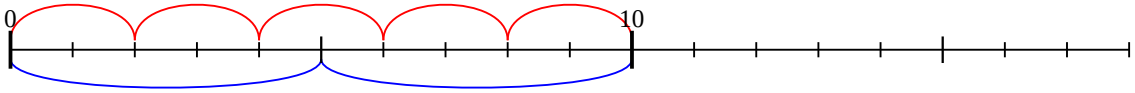

7) 3 × 8 =
8 × 3 =

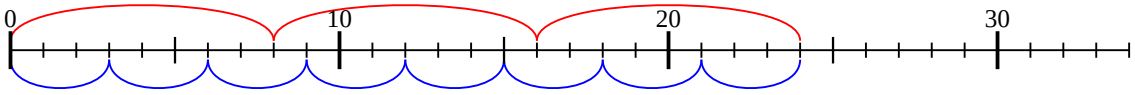

8) 3 × 2 =
2 × 3 =

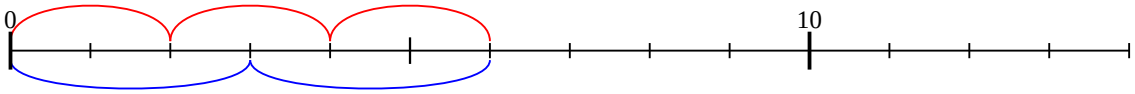

9) 2 × 6 =
6 × 2 =

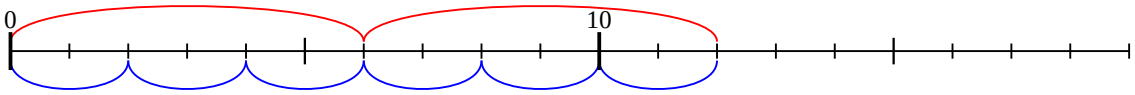

10) 2 × 2 =
2 × 2 =



11) 3 × 5 =
5 × 3 =

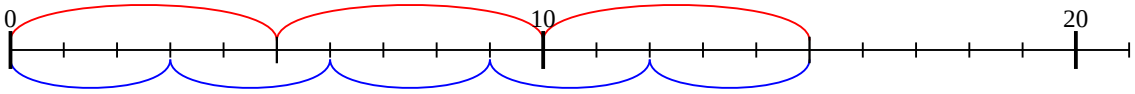

Respuestas

1. **36**
2. **12**
3. **18**
4. **20**
5. **12**
6. **10**
7. **24**
8. **6**
9. **12**
10. **4**
11. **15**