Máquinas de Funciones - (Sumar y Restar) Nombre:

Determina la regla que cada máquina de función está usando.

Ej)

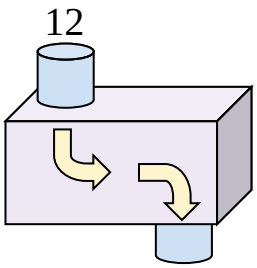

Sumar 37

1)

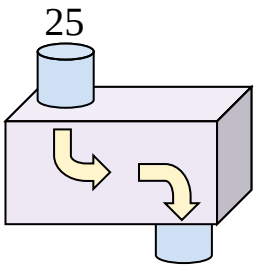

2)

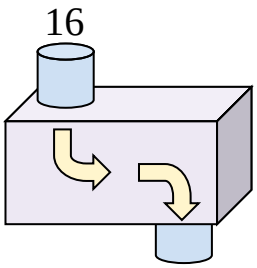

3)

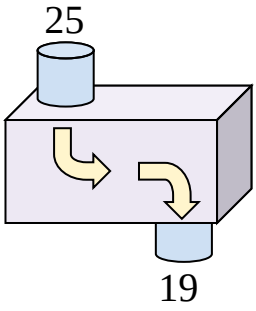

4)

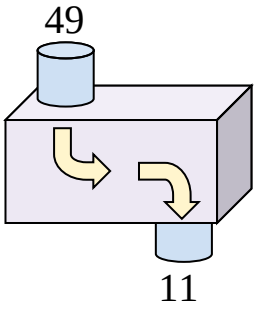

5)

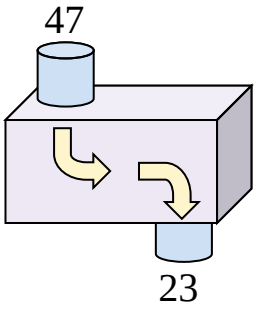

6)

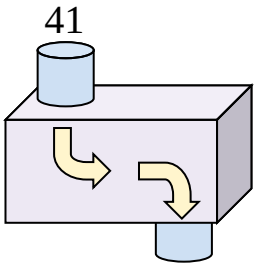

7)

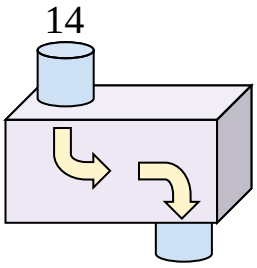

8)

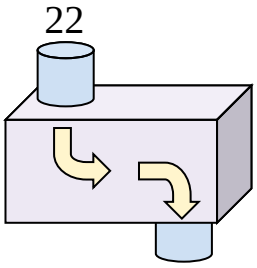

9)

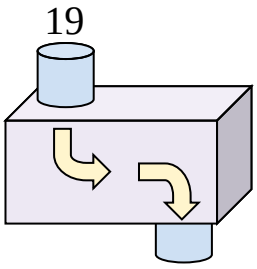

10)

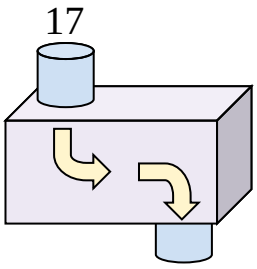

11)

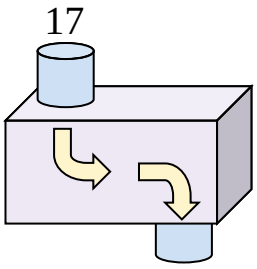

Respuestas

Ej. Sumar 37

1. _____
2. _____
3. _____
4. _____
5. _____
6. _____
7. _____
8. _____
9. _____
10. _____
11. _____

1-10	91	82	73	64	55	45	36	27	18	9
11	0									

Determina la regla que cada máquina de función está usando.

Ej)

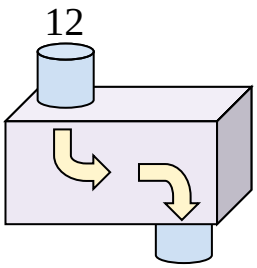

Sumar 37

1)

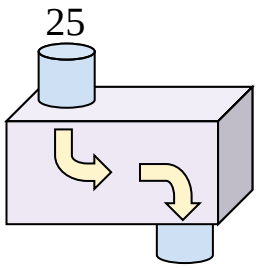

Restar 13

2)

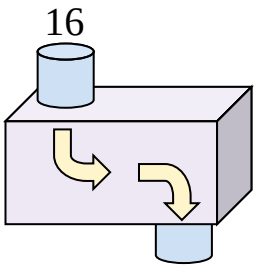

Sumar 26

3)

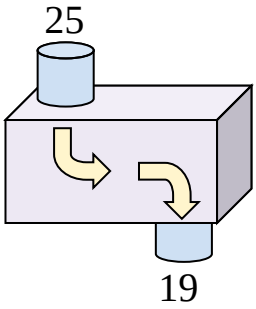

Restar 6

4)

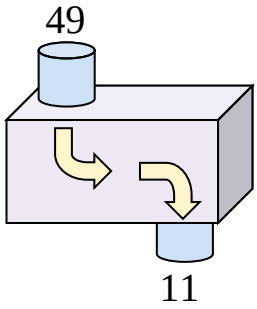

Restar 38

5)

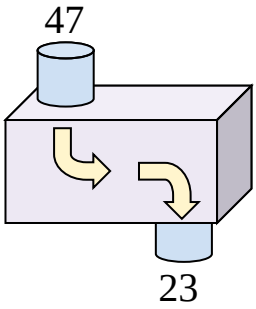

Restar 24

6)

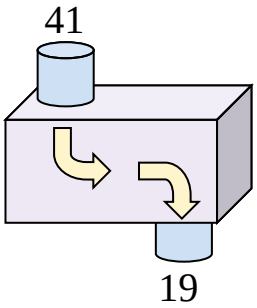

Restar 22

7)

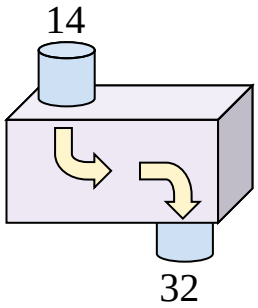

Sumar 18

8)

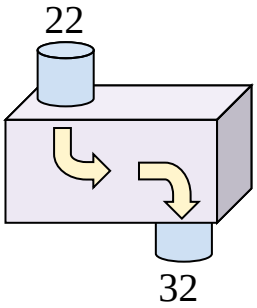

Sumar 10

9)

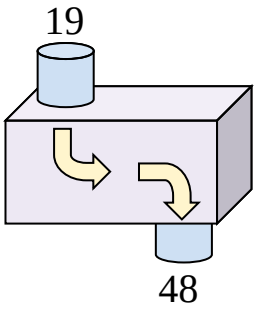

Sumar 29

10)

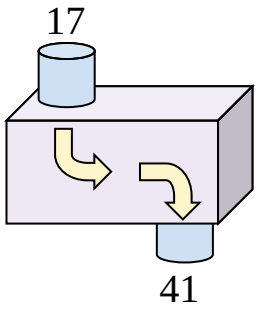

Sumar 24

11)

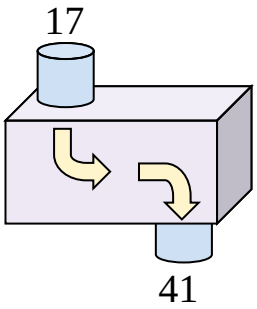

Sumar 24

Respuestas

Ej.	Sumar 37
1.	Restar 13
2.	Sumar 26
3.	Restar 6
4.	Restar 38
5.	Restar 24
6.	Restar 22
7.	Sumar 18
8.	Sumar 10
9.	Sumar 29
10.	Sumar 24
11.	Sumar 24

1-10	91	82	73	64	55	45	36	27	18	9
11	0									