Máquinas de Funciones - (Sumar y Restar) Nombre:

Determina la regla que cada máquina de función está usando.

Ej)

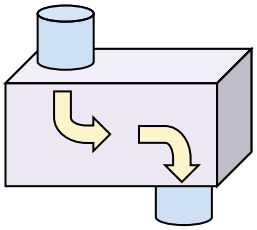

Restar 17

1)

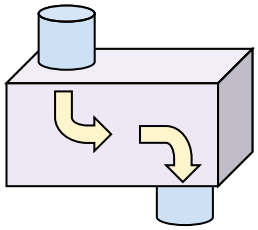

2)

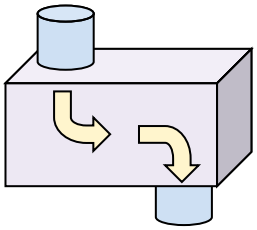

3)

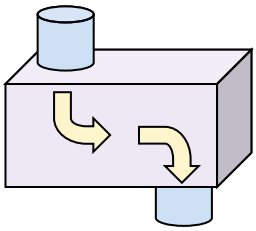

4)

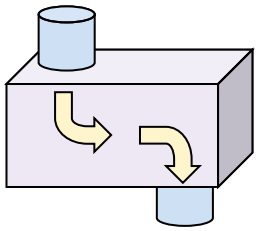

5)

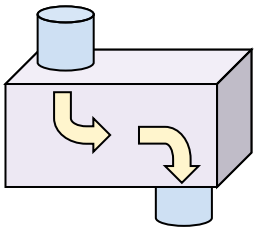

6)

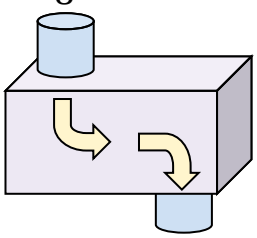

7)

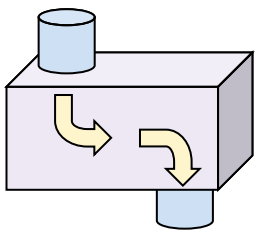

8)

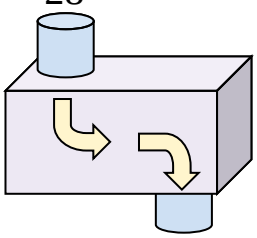

9)

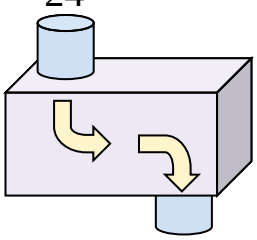

10)

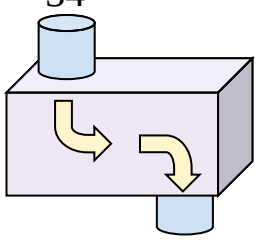

11)

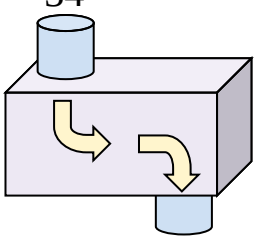

Respuestas

Ej. Restar 17

1. _____
2. _____
3. _____
4. _____
5. _____
6. _____
7. _____
8. _____
9. _____
10. _____
11. _____

1-10	91	82	73	64	55	45	36	27	18	9
11	0									

Nombre: **Clave De Respuestas**

Determina la regla que cada máquina de función está usando.

Ej)

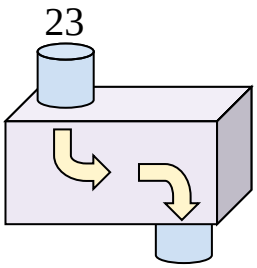

Restar 17

1)

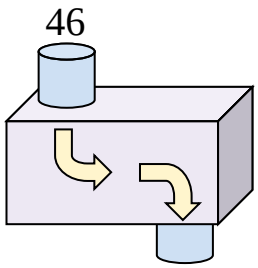

Restar 27

2)

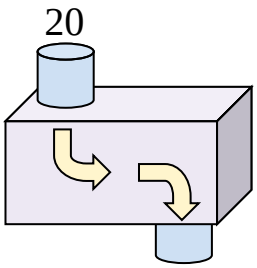

Restar 11

3)

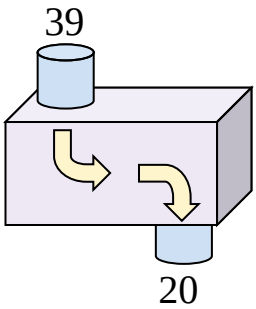

Restar 19

4)

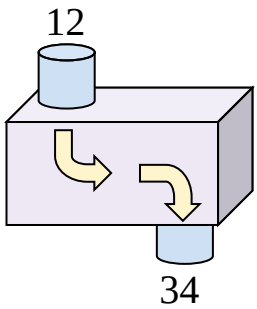

Sumar 22

5)

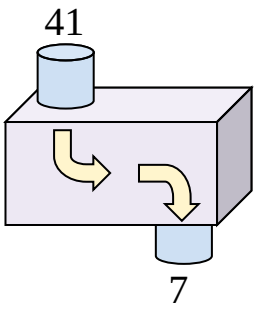

Restar 34

6)

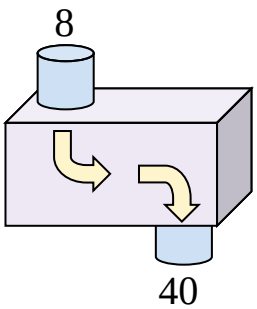

Sumar 32

7)

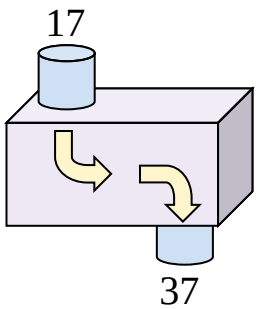

Sumar 20

8)

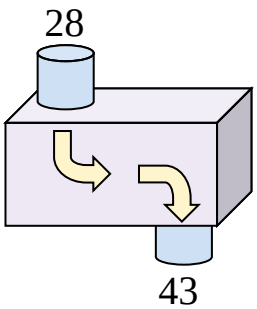

Sumar 15

9)

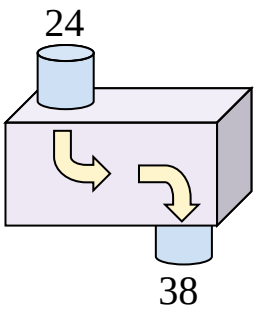

Sumar 14

10)

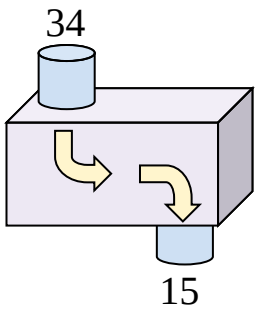

Restar 19

11)

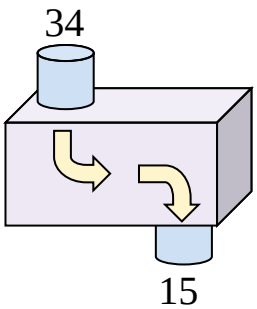

Restar 19

Respuestas

Ej.	Restar 17
1.	Restar 27
2.	Restar 11
3.	Restar 19
4.	Sumar 22
5.	Restar 34
6.	Sumar 32
7.	Sumar 20
8.	Sumar 15
9.	Sumar 14
10.	Restar 19
11.	Restar 19

1-10	91	82	73	64	55	45	36	27	18	9
11	0									