Encuentra la longitud del lado faltante del rectángulo. Nombre:

Encuentra el valor de X para cada figura. Cada figura está en centímetros (cm). No a escala.

1) area = 54 cm^2

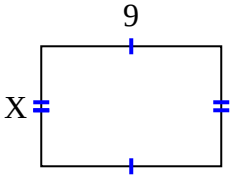

2) area = 21 cm^2

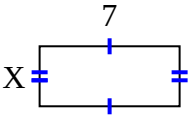

3) area = 9 cm^2

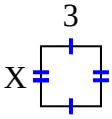

4) area = 4 cm^2

5) area = 27 cm^2

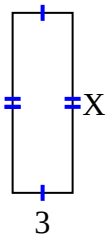

6) area = 28 cm^2

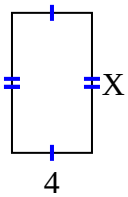

7) area = 20 cm^2

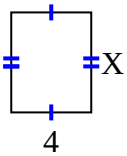

8) area = 32 cm^2

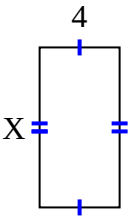

9) area = 20 cm^2

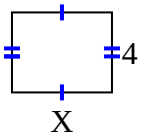

10) area = 40 cm^2

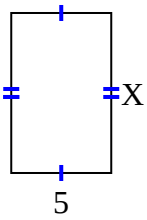

11) area = 28 cm^2

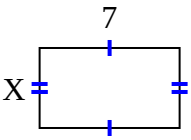

12) area = 54 cm^2

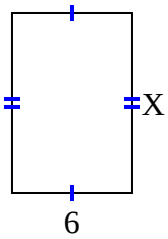

13) area = 16 cm^2

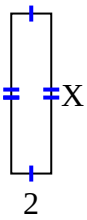

14) area = 24 cm^2

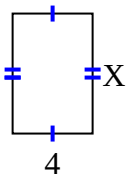

15) area = 56 cm^2

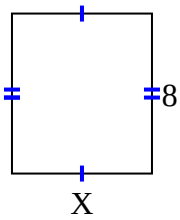

Respuestas

1. _____
2. _____
3. _____
4. _____
5. _____
6. _____
7. _____
8. _____
9. _____
10. _____
11. _____
12. _____
13. _____
14. _____
15. _____

1-10	93	87	80	73	67	60	53	47	40	33
11-15	27	20	13	7	0					

Encuentra la longitud del lado faltante del rectángulo. Nombre: **Clave De Respuestas**

Encuentra el valor de X para cada figura. Cada figura está en centímetros (cm). No a escala.

1) area = 54 cm^2

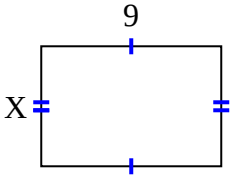

2) area = 21 cm^2

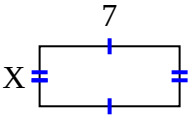

3) area = 9 cm^2

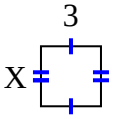

4) area = 4 cm^2

5) area = 27 cm^2

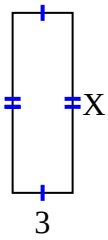

6) area = 28 cm^2

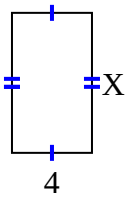

7) area = 20 cm^2

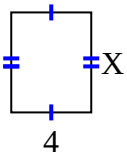

8) area = 32 cm^2

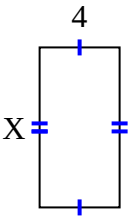

9) area = 20 cm^2

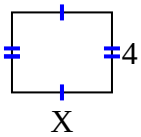

10) area = 40 cm^2

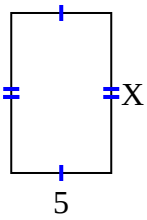

11) area = 28 cm^2

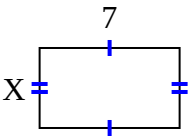

12) area = 54 cm^2

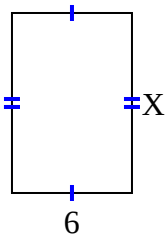

13) area = 16 cm^2

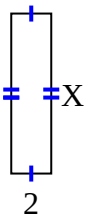

14) area = 24 cm^2

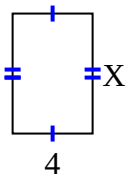

15) area = 56 cm^2

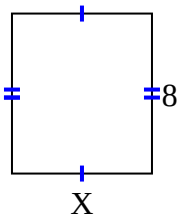

Respuestas

1. 6
2. 3
3. 3
4. 2
5. 9
6. 7
7. 5
8. 8
9. 5
10. 8
11. 4
12. 9
13. 8
14. 6
15. 7

1-10	93	87	80	73	67	60	53	47	40	33
11-15	27	20	13	7	0					

Encuentra la longitud del lado faltante del rectángulo. Nombre:

Encuentra el valor de X para cada figura. Cada figura está en centímetros (cm). No a escala.

1) area = 24 cm^2

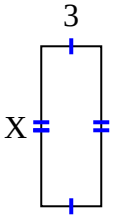

2) area = 18 cm^2

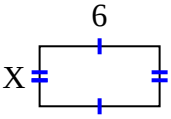

3) area = 4 cm^2

4) area = 56 cm^2

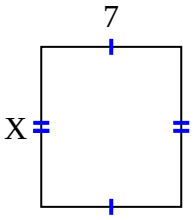

5) area = 14 cm^2

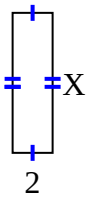

6) area = 12 cm^2

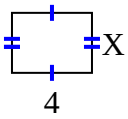

7) area = 72 cm^2

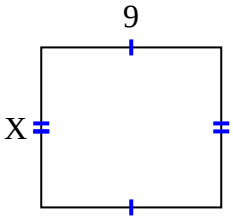

8) area = 30 cm^2

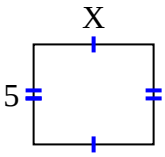

9) area = 40 cm^2

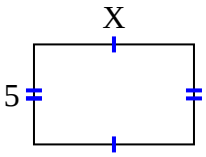

10) area = 72 cm^2

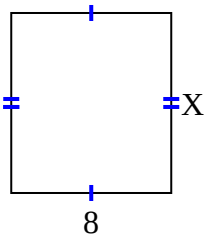

11) area = 18 cm^2

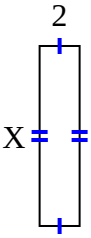

12) area = 27 cm^2

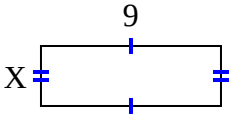

13) area = 12 cm^2

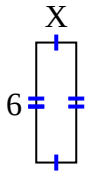

14) area = 42 cm^2

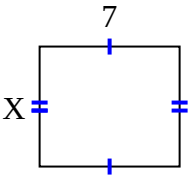

15) area = 20 cm^2

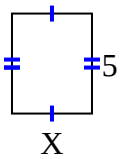

Respuestas

1. _____
2. _____
3. _____
4. _____
5. _____
6. _____
7. _____
8. _____
9. _____
10. _____
11. _____
12. _____
13. _____
14. _____
15. _____

1-10	93	87	80	73	67	60	53	47	40	33
11-15	27	20	13	7	0					

Encuentra la longitud del lado faltante del rectángulo. Nombre: **Clave De Respuestas**

Encuentra el valor de X para cada figura. Cada figura está en centímetros (cm). No a escala.

1) area = 24 cm^2

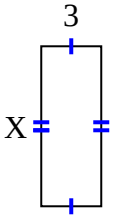

2) area = 18 cm^2

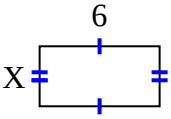

3) area = 4 cm^2

4) area = 56 cm^2

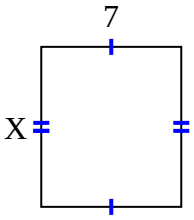

5) area = 14 cm^2

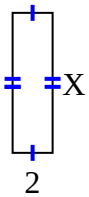

6) area = 12 cm^2

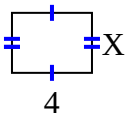

7) area = 72 cm^2

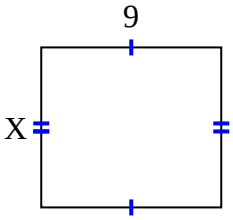

8) area = 30 cm^2

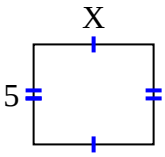

9) area = 40 cm^2

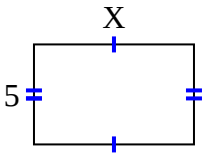

10) area = 72 cm^2

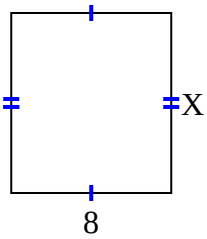

11) area = 18 cm^2

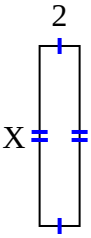

12) area = 27 cm^2

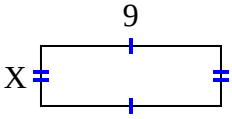

13) area = 12 cm^2

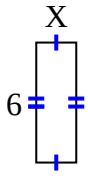

14) area = 42 cm^2

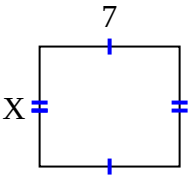

15) area = 20 cm^2

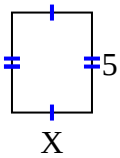

Respuestas

1. 8
2. 3
3. 2
4. 8
5. 7
6. 3
7. 8
8. 6
9. 8
10. 9
11. 9
12. 3
13. 2
14. 6
15. 4

1-10	93	87	80	73	67	60	53	47	40	33
11-15	27	20	13	7	0					

Encuentra la longitud del lado faltante del rectángulo. Nombre:

Encuentra el valor de X para cada figura. Cada figura está en centímetros (cm). No a escala.

1) area = 8 cm^2

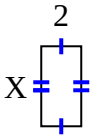

2) area = 54 cm^2

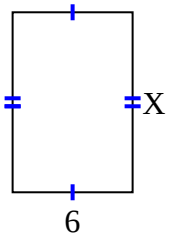

3) area = 6 cm^2

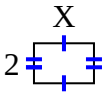

4) area = 10 cm^2

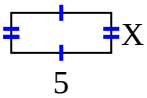

5) area = 15 cm^2

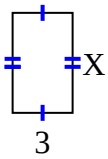

6) area = 12 cm^2

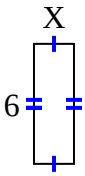

7) area = 16 cm^2

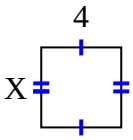

8) area = 18 cm^2

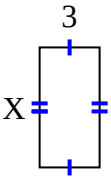

9) area = 42 cm^2

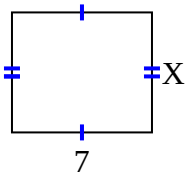

10) area = 30 cm^2

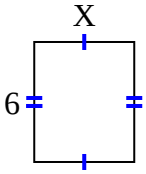

11) area = 36 cm^2

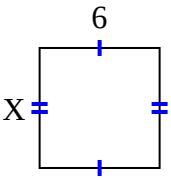

12) area = 6 cm^2

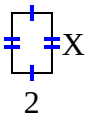

13) area = 16 cm^2

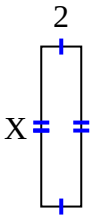

14) area = 9 cm^2

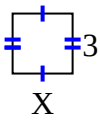

15) area = 72 cm^2

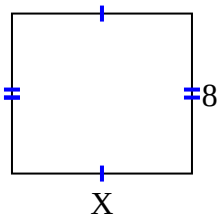

Respuestas

1. _____
2. _____
3. _____
4. _____
5. _____
6. _____
7. _____
8. _____
9. _____
10. _____
11. _____
12. _____
13. _____
14. _____
15. _____

1-10	93	87	80	73	67	60	53	47	40	33
11-15	27	20	13	7	0					

Encuentra la longitud del lado faltante del rectángulo. Nombre: **Clave De Respuestas**

Encuentra el valor de X para cada figura. Cada figura está en centímetros (cm). No a escala.

1) area = 8 cm^2

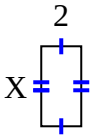

2) area = 54 cm^2

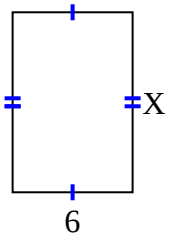

3) area = 6 cm^2

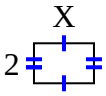

4) area = 10 cm^2

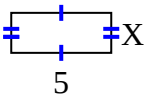

5) area = 15 cm^2

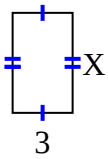

6) area = 12 cm^2

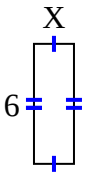

7) area = 16 cm^2

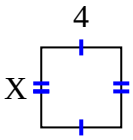

8) area = 18 cm^2

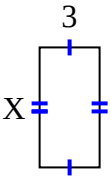

9) area = 42 cm^2

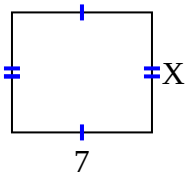

10) area = 30 cm^2

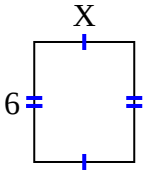

11) area = 36 cm^2

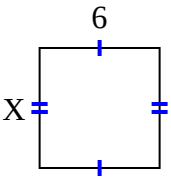

12) area = 6 cm^2

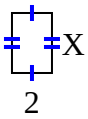

13) area = 16 cm^2

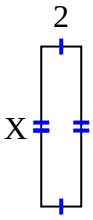

14) area = 9 cm^2

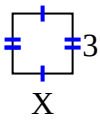

15) area = 72 cm^2

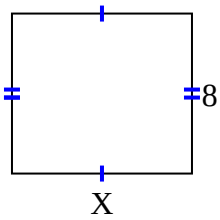

Respuestas

1. 4
2. 9
3. 3
4. 2
5. 5
6. 2
7. 4
8. 6
9. 6
10. 5
11. 6
12. 3
13. 8
14. 3
15. 9

1-10	93	87	80	73	67	60	53	47	40	33
11-15	27	20	13	7	0					

Encuentra la longitud del lado faltante del rectángulo. Nombre:

Encuentra el valor de X para cada figura. Cada figura está en centímetros (cm). No a escala.

1) area = 15 cm^2

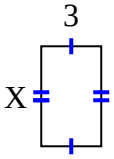

2) area = 56 cm^2

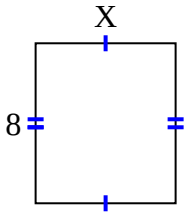

3) area = 24 cm^2

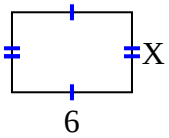

4) area = 32 cm^2

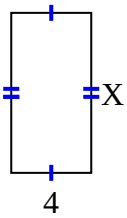

5) area = 48 cm^2

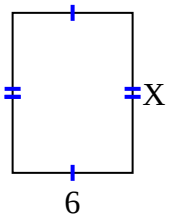

6) area = 12 cm^2

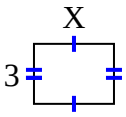

7) area = 21 cm^2

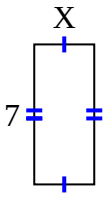

8) area = 16 cm^2

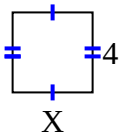

9) area = 12 cm^2

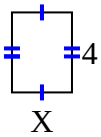

10) area = 42 cm^2

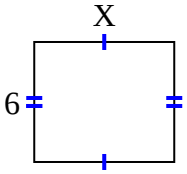

11) area = 40 cm^2

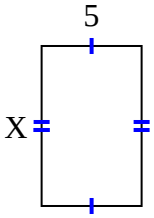

12) area = 54 cm^2

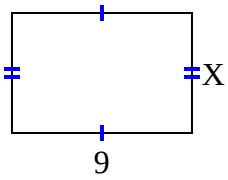

13) area = 72 cm^2

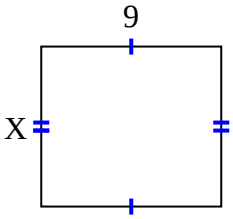

14) area = 18 cm^2

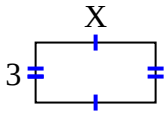

15) area = 63 cm^2

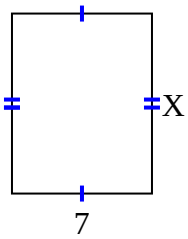

Respuestas

1. _____
2. _____
3. _____
4. _____
5. _____
6. _____
7. _____
8. _____
9. _____
10. _____
11. _____
12. _____
13. _____
14. _____
15. _____

1-10	93	87	80	73	67	60	53	47	40	33
11-15	27	20	13	7	0					

Encuentra la longitud del lado faltante del rectángulo. Nombre: **Clave De Respuestas**

Encuentra el valor de X para cada figura. Cada figura está en centímetros (cm). No a escala.

1) area = 15 cm^2

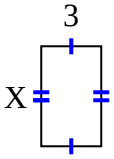

2) area = 56 cm^2

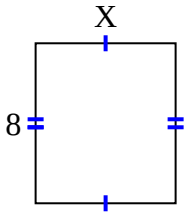

3) area = 24 cm^2

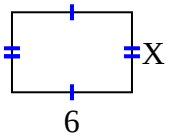

4) area = 32 cm^2

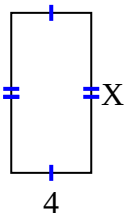

5) area = 48 cm^2

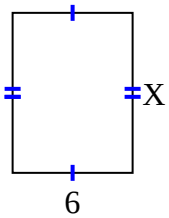

6) area = 12 cm^2

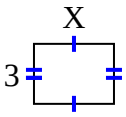

7) area = 21 cm^2

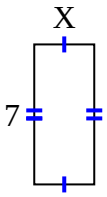

8) area = 16 cm^2

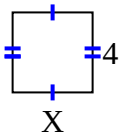

9) area = 12 cm^2

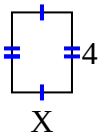

10) area = 42 cm^2

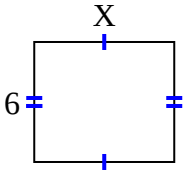

11) area = 40 cm^2

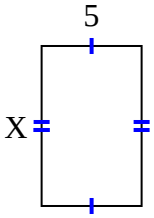

12) area = 54 cm^2

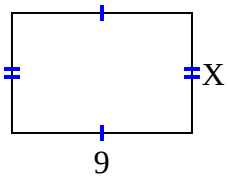

13) area = 72 cm^2

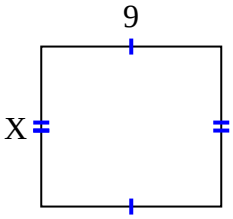

14) area = 18 cm^2

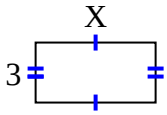

15) area = 63 cm^2

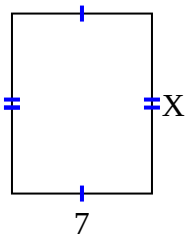

Respuestas

1. 5
2. 7
3. 4
4. 8
5. 8
6. 4
7. 3
8. 4
9. 3
10. 7
11. 8
12. 6
13. 8
14. 6
15. 9

1-10	93	87	80	73	67	60	53	47	40	33
11-15	27	20	13	7	0					

Encuentra la longitud del lado faltante del rectángulo. Nombre:

Encuentra el valor de X para cada figura. Cada figura está en centímetros (cm). No a escala.

1) area = 4 cm^2

2) area = 21 cm^2

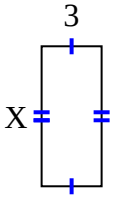

3) area = 35 cm^2

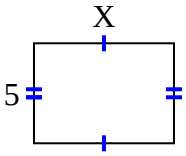

4) area = 20 cm^2

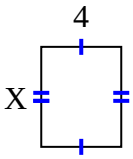

5) area = 12 cm^2

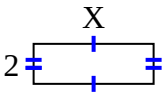

6) area = 12 cm^2

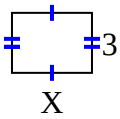

7) area = 56 cm^2

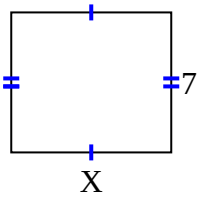

8) area = 63 cm^2

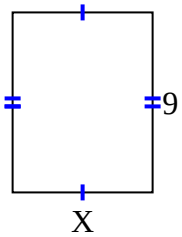

9) area = 18 cm^2

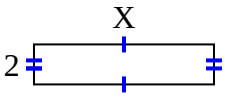

10) area = 15 cm^2

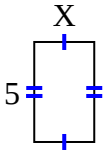

11) area = 6 cm^2

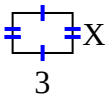

12) area = 16 cm^2

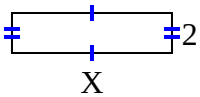

13) area = 8 cm^2

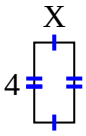

14) area = 49 cm^2

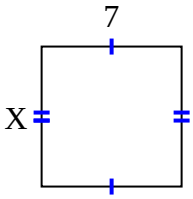

15) area = 54 cm^2

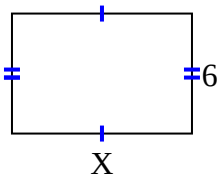

Respuestas

1. _____
2. _____
3. _____
4. _____
5. _____
6. _____
7. _____
8. _____
9. _____
10. _____
11. _____
12. _____
13. _____
14. _____
15. _____

1-10	93	87	80	73	67	60	53	47	40	33
11-15	27	20	13	7	0					

Encuentra la longitud del lado faltante del rectángulo. Nombre: **Clave De Respuestas**

Encuentra el valor de X para cada figura. Cada figura está en centímetros (cm). No a escala.

1) area = 4 cm^2

2) area = 21 cm^2

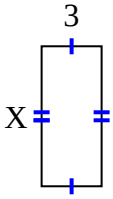

3) area = 35 cm^2

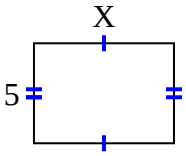

4) area = 20 cm^2

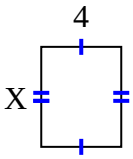

5) area = 12 cm^2

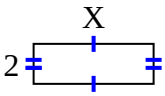

6) area = 12 cm^2

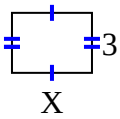

7) area = 56 cm^2

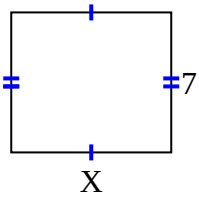

8) area = 63 cm^2

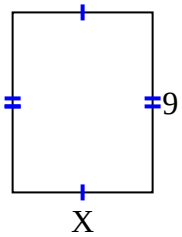

9) area = 18 cm^2

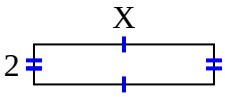

10) area = 15 cm^2

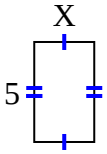

11) area = 6 cm^2

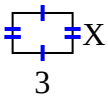

12) area = 16 cm^2

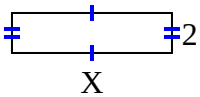

13) area = 8 cm^2

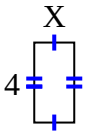

14) area = 49 cm^2

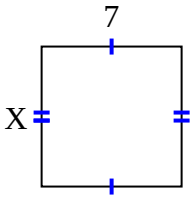

15) area = 54 cm^2

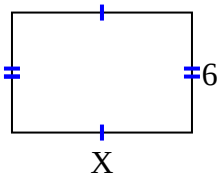

Respuestas

1. 2
2. 7
3. 7
4. 5
5. 6
6. 4
7. 8
8. 7
9. 9
10. 3
11. 2
12. 8
13. 2
14. 7
15. 9

1-10	93	87	80	73	67	60	53	47	40	33
11-15	27	20	13	7	0					

Encuentra la longitud del lado faltante del rectángulo. Nombre:

Encuentra el valor de X para cada figura. Cada figura está en centímetros (cm). No a escala.

1) area = 56 cm^2

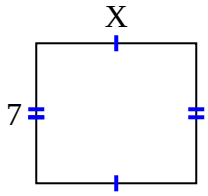

2) area = 36 cm^2

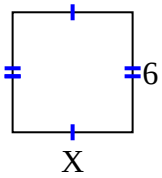

3) area = 32 cm^2

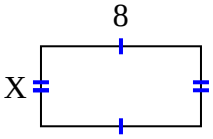

4) area = 72 cm^2

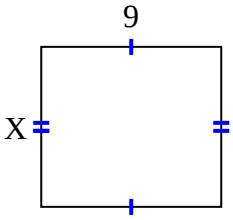

5) area = 12 cm^2

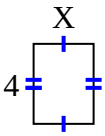

6) area = 63 cm^2

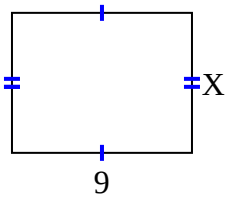

7) area = 18 cm^2

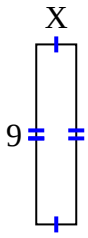

8) area = 40 cm^2

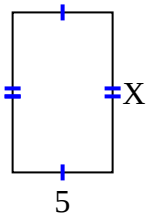

9) area = 18 cm^2

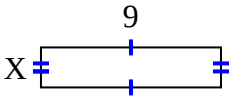

10) area = 30 cm^2

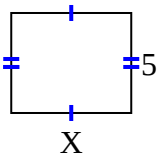

11) area = 15 cm^2

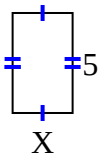

12) area = 15 cm^2

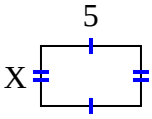

13) area = 45 cm^2

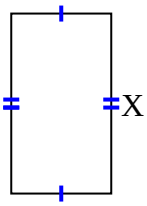

14) area = 72 cm^2

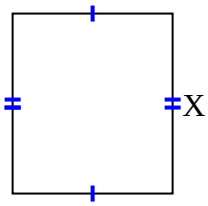

15) area = 16 cm^2

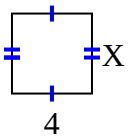

Respuestas

1. _____
2. _____
3. _____
4. _____
5. _____
6. _____
7. _____
8. _____
9. _____
10. _____
11. _____
12. _____
13. _____
14. _____
15. _____

1-10	93	87	80	73	67	60	53	47	40	33
11-15	27	20	13	7	0					

Encuentra la longitud del lado faltante del rectángulo. Nombre: **Clave De Respuestas**

Encuentra el valor de X para cada figura. Cada figura está en centímetros (cm). No a escala.

1) area = 56 cm^2

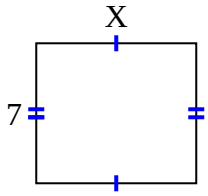

2) area = 36 cm^2

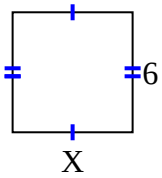

3) area = 32 cm^2

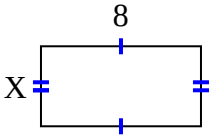

4) area = 72 cm^2

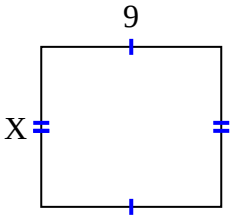

5) area = 12 cm^2

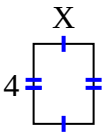

6) area = 63 cm^2

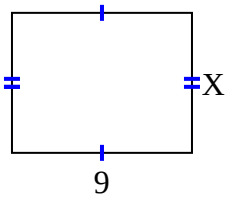

7) area = 18 cm^2

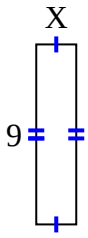

8) area = 40 cm^2

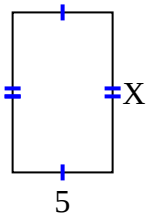

9) area = 18 cm^2

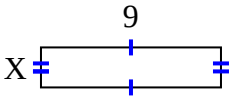

10) area = 30 cm^2

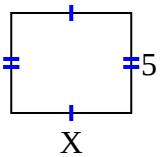

11) area = 15 cm^2

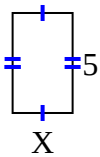

12) area = 15 cm^2

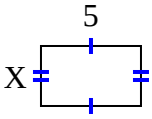

13) area = 45 cm^2

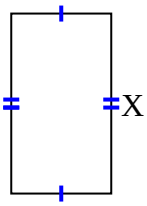

14) area = 72 cm^2

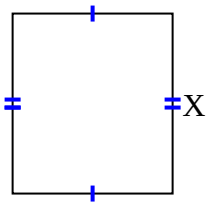

15) area = 16 cm^2

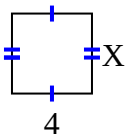

Respuestas

1. 8
2. 6
3. 4
4. 8
5. 3
6. 7
7. 2
8. 8
9. 2
10. 6
11. 3
12. 3
13. 9
14. 9
15. 4

1-10	93	87	80	73	67	60	53	47	40	33
11-15	27	20	13	7	0					

Encuentra la longitud del lado faltante del rectángulo. Nombre:

Encuentra el valor de X para cada figura. Cada figura está en centímetros (cm). No a escala.

1) area = 18 cm^2

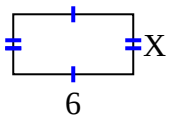

2) area = 6 cm^2

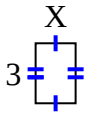

3) area = 56 cm^2

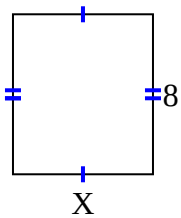

4) area = 36 cm^2

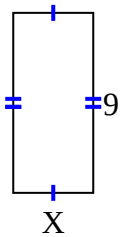

5) area = 12 cm^2

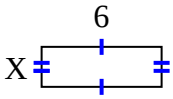

6) area = 63 cm^2

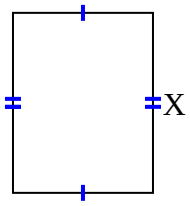

7) area = 36 cm^2

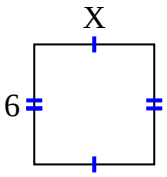

8) area = 12 cm^2

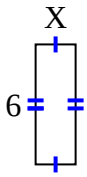

9) area = 42 cm^2

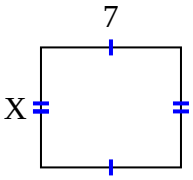

10) area = 24 cm^2

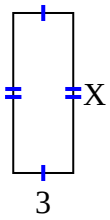

11) area = 27 cm^2

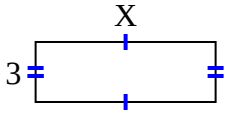

12) area = 27 cm^2

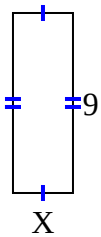

13) area = 20 cm^2

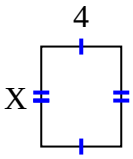

14) area = 6 cm^2

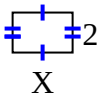

15) area = 48 cm^2

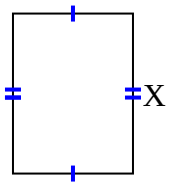

Respuestas

1. _____
2. _____
3. _____
4. _____
5. _____
6. _____
7. _____
8. _____
9. _____
10. _____
11. _____
12. _____
13. _____
14. _____
15. _____

1-10	93	87	80	73	67	60	53	47	40	33
11-15	27	20	13	7	0					

Encuentra la longitud del lado faltante del rectángulo. Nombre: **Clave De Respuestas**

Encuentra el valor de X para cada figura. Cada figura está en centímetros (cm). No a escala.

1) area = 18 cm^2

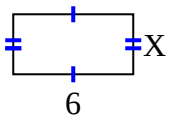

2) area = 6 cm^2

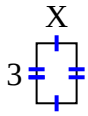

3) area = 56 cm^2

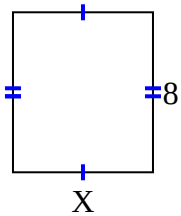

4) area = 36 cm^2

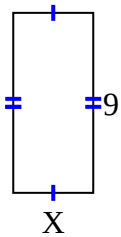

5) area = 12 cm^2

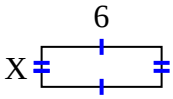

6) area = 63 cm^2

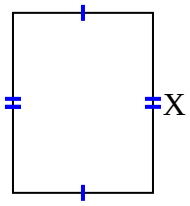

7) area = 36 cm^2

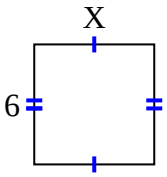

8) area = 12 cm^2

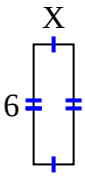

9) area = 42 cm^2

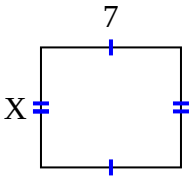

10) area = 24 cm^2

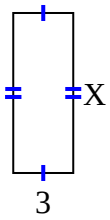

11) area = 27 cm^2

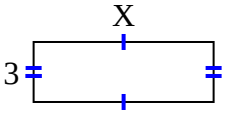

12) area = 27 cm^2

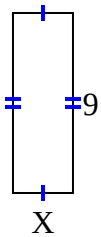

13) area = 20 cm^2

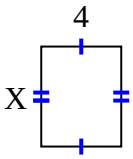

14) area = 6 cm^2

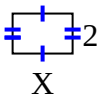

15) area = 48 cm^2

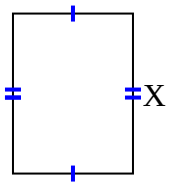

Respuestas

1. 3
2. 2
3. 7
4. 4
5. 2
6. 9
7. 6
8. 2
9. 6
10. 8
11. 9
12. 3
13. 5
14. 3
15. 8

1-10	93	87	80	73	67	60	53	47	40	33
11-15	27	20	13	7	0					

Encuentra la longitud del lado faltante del rectángulo. Nombre:

Encuentra el valor de X para cada figura. Cada figura está en centímetros (cm). No a escala.

1) area = 32 cm^2

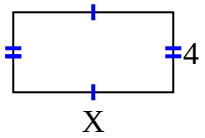

2) area = 10 cm^2

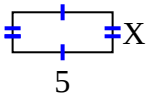

3) area = 24 cm^2

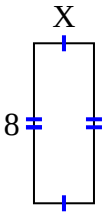

4) area = 28 cm^2

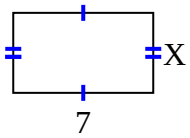

5) area = 54 cm^2

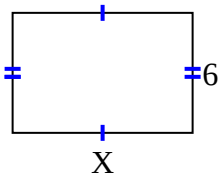

6) area = 30 cm^2

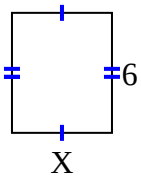

7) area = 12 cm^2

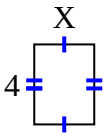

8) area = 15 cm^2

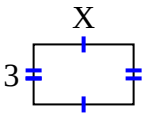

9) area = 64 cm^2

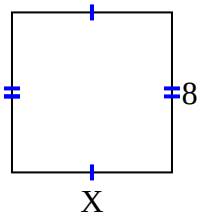

10) area = 28 cm^2

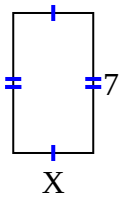

11) area = 30 cm^2

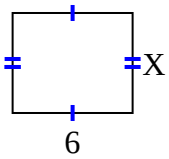

12) area = 42 cm^2

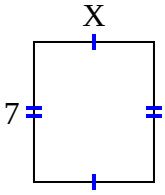

13) area = 56 cm^2

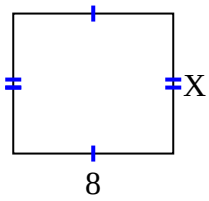

14) area = 16 cm^2

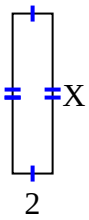

15) area = 48 cm^2

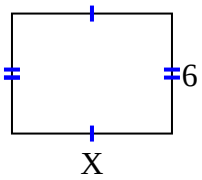

Respuestas

1. _____
2. _____
3. _____
4. _____
5. _____
6. _____
7. _____
8. _____
9. _____
10. _____
11. _____
12. _____
13. _____
14. _____
15. _____

1-10	93	87	80	73	67	60	53	47	40	33
11-15	27	20	13	7	0					

Encuentra la longitud del lado faltante del rectángulo. Nombre: **Clave De Respuestas**

Encuentra el valor de X para cada figura. Cada figura está en centímetros (cm). No a escala.

1) area = 32 cm^2

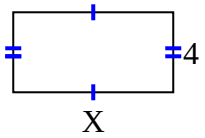

2) area = 10 cm^2

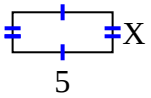

3) area = 24 cm^2

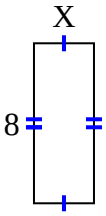

4) area = 28 cm^2

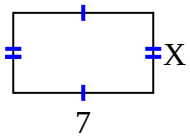

5) area = 54 cm^2

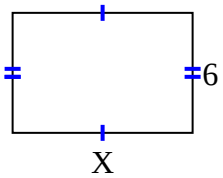

6) area = 30 cm^2

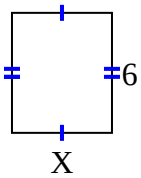

7) area = 12 cm^2

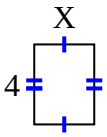

8) area = 15 cm^2

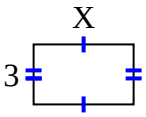

9) area = 64 cm^2

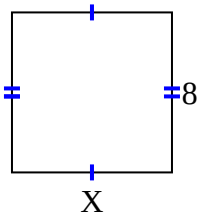

10) area = 28 cm^2

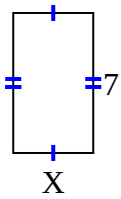

11) area = 30 cm^2

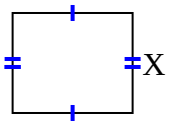

12) area = 42 cm^2

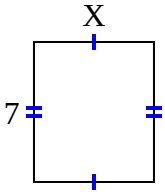

13) area = 56 cm^2

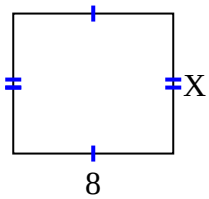

14) area = 16 cm^2

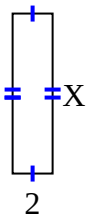

15) area = 48 cm^2

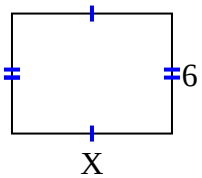

Respuestas

1. 8
2. 2
3. 3
4. 4
5. 9
6. 5
7. 3
8. 5
9. 8
10. 4
11. 5
12. 6
13. 7
14. 8
15. 8

1-10	93	87	80	73	67	60	53	47	40	33
11-15	27	20	13	7	0					

Encuentra la longitud del lado faltante del rectángulo. Nombre:

Encuentra el valor de X para cada figura. Cada figura está en centímetros (cm). No a escala.

1) area = 15 cm^2

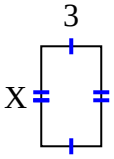

2) area = 14 cm^2

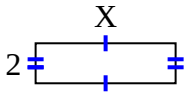

3) area = 18 cm^2

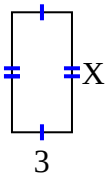

4) area = 20 cm^2

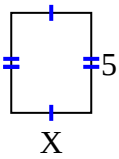

5) area = 63 cm^2

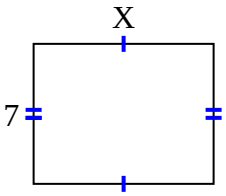

6) area = 18 cm^2

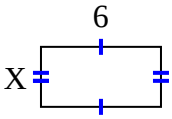

7) area = 72 cm^2

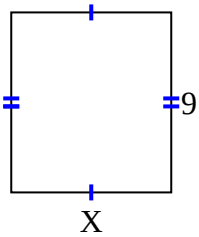

8) area = 16 cm^2

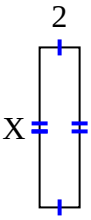

9) area = 21 cm^2

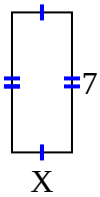

10) area = 24 cm^2

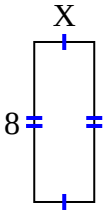

11) area = 16 cm^2

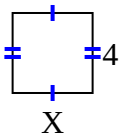

12) area = 18 cm^2

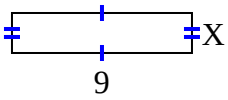

13) area = 27 cm^2

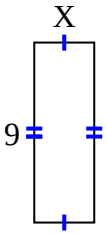

14) area = 24 cm^2

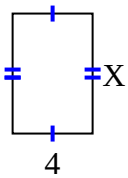

15) area = 45 cm^2

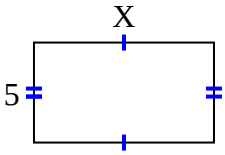

Respuestas

1. _____
2. _____
3. _____
4. _____
5. _____
6. _____
7. _____
8. _____
9. _____
10. _____
11. _____
12. _____
13. _____
14. _____
15. _____

1-10	93	87	80	73	67	60	53	47	40	33
11-15	27	20	13	7	0					

Encuentra la longitud del lado faltante del rectángulo. Nombre: **Clave De Respuestas**

Encuentra el valor de X para cada figura. Cada figura está en centímetros (cm). No a escala.

1) area = 15 cm^2

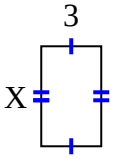

2) area = 14 cm^2

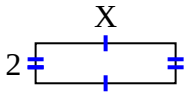

3) area = 18 cm^2

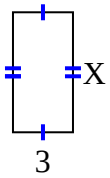

4) area = 20 cm^2

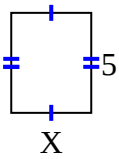

5) area = 63 cm^2

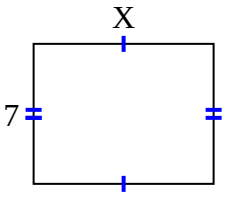

6) area = 18 cm^2

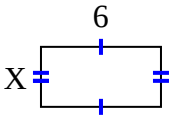

7) area = 72 cm^2

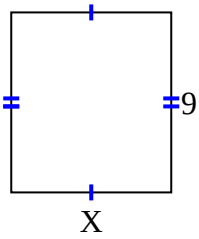

8) area = 16 cm^2

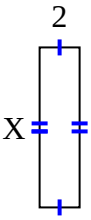

9) area = 21 cm^2

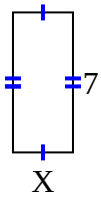

10) area = 24 cm^2

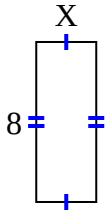

11) area = 16 cm^2

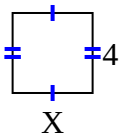

12) area = 18 cm^2

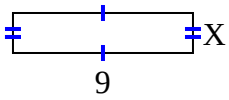

13) area = 27 cm^2

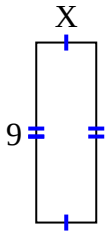

14) area = 24 cm^2

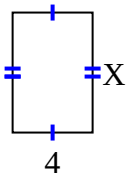

15) area = 45 cm^2

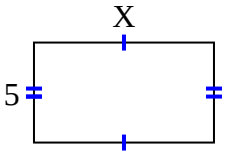

Respuestas

1. 5
2. 7
3. 6
4. 4
5. 9
6. 3
7. 8
8. 8
9. 3
10. 3
11. 4
12. 2
13. 3
14. 6
15. 9

1-10	93	87	80	73	67	60	53	47	40	33
11-15	27	20	13	7	0					

Encuentra la longitud del lado faltante del rectángulo. Nombre:

Encuentra el valor de X para cada figura. Cada figura está en centímetros (cm). No a escala.

1) area = 30 cm^2

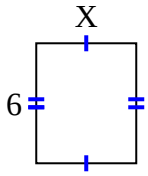

2) area = 45 cm^2

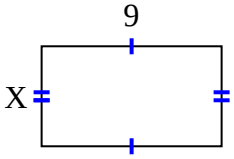

3) area = 27 cm^2

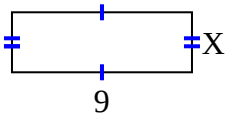

4) area = 56 cm^2

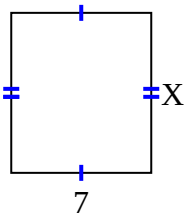

5) area = 63 cm^2

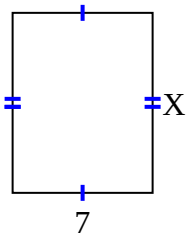

6) area = 14 cm^2

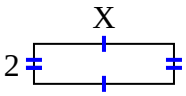

7) area = 35 cm^2

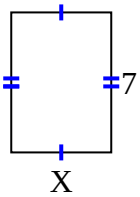

8) area = 18 cm^2

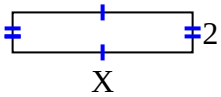

9) area = 32 cm^2

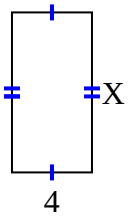

10) area = 42 cm^2

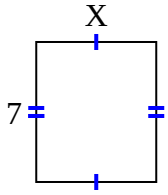

11) area = 6 cm^2

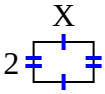

12) area = 16 cm^2

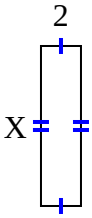

13) area = 6 cm^2

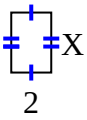

14) area = 63 cm^2

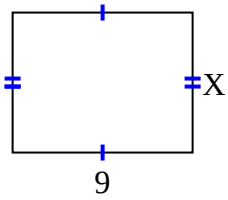

15) area = 15 cm^2

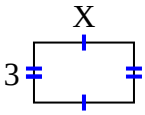

Respuestas

1. _____
2. _____
3. _____
4. _____
5. _____
6. _____
7. _____
8. _____
9. _____
10. _____
11. _____
12. _____
13. _____
14. _____
15. _____

1-10	93	87	80	73	67	60	53	47	40	33
11-15	27	20	13	7	0					

Encuentra la longitud del lado faltante del rectángulo. Nombre: **Clave De Respuestas**

Encuentra el valor de X para cada figura. Cada figura está en centímetros (cm). No a escala.

1) area = 30 cm^2

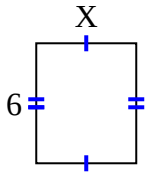

2) area = 45 cm^2

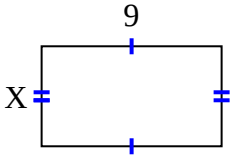

3) area = 27 cm^2

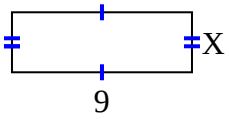

4) area = 56 cm^2

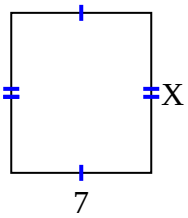

5) area = 63 cm^2

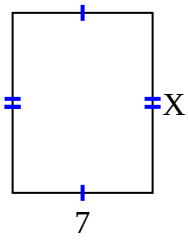

6) area = 14 cm^2

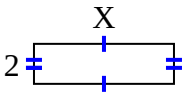

7) area = 35 cm^2

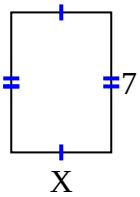

8) area = 18 cm^2

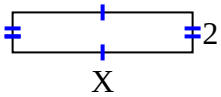

9) area = 32 cm^2

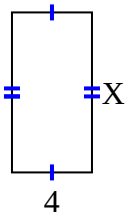

10) area = 42 cm^2

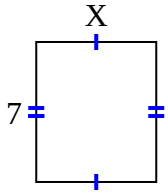

11) area = 6 cm^2

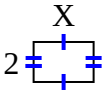

12) area = 16 cm^2

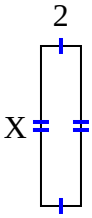

13) area = 6 cm^2

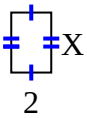

14) area = 63 cm^2

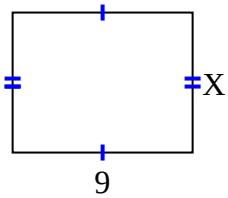

15) area = 15 cm^2

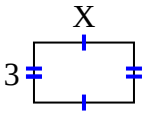

Respuestas

1. 5
2. 5
3. 3
4. 8
5. 9
6. 7
7. 5
8. 9
9. 8
10. 6
11. 3
12. 8
13. 3
14. 7
15. 5

1-10	93	87	80	73	67	60	53	47	40	33
11-15	27	20	13	7	0					