Encuentra la longitud del lado faltante del rectángulo. Nombre:

Encuentra el valor de X para cada figura. Cada figura está en centímetros (cm). No a escala.

1) area = 32 cm^2

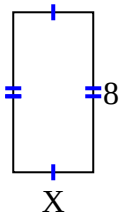

2) area = 18 cm^2

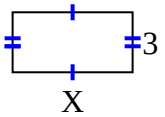

3) area = 18 cm^2

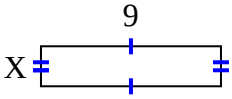

4) area = 16 cm^2

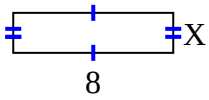

5) area = 8 cm^2

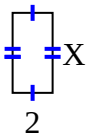

6) area = 56 cm^2

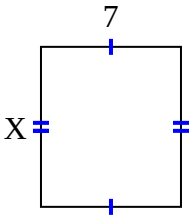

7) area = 63 cm^2

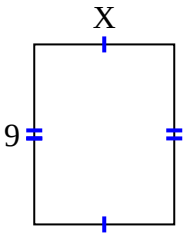

8) area = 81 cm^2

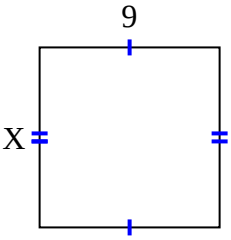

9) area = 20 cm^2

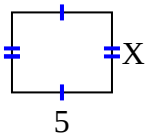

10) area = 14 cm^2

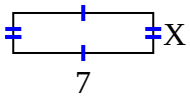

11) area = 9 cm^2

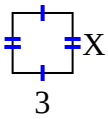

12) area = 54 cm^2

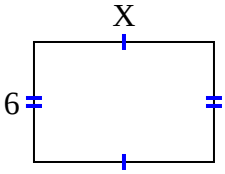

13) area = 16 cm^2

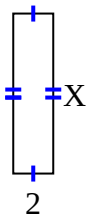

14) area = 15 cm^2

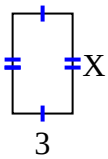

15) area = 49 cm^2

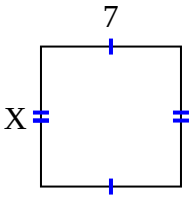

Respuestas

1. _____
2. _____
3. _____
4. _____
5. _____
6. _____
7. _____
8. _____
9. _____
10. _____
11. _____
12. _____
13. _____
14. _____
15. _____

1-10	93	87	80	73	67	60	53	47	40	33
11-15	27	20	13	7	0					

Encuentra la longitud del lado faltante del rectángulo. Nombre: **Clave De Respuestas**

Encuentra el valor de X para cada figura. Cada figura está en centímetros (cm). No a escala.

1) area = 32 cm^2

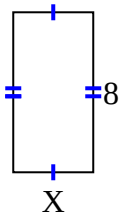

2) area = 18 cm^2

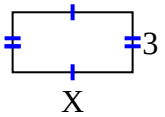

3) area = 18 cm^2

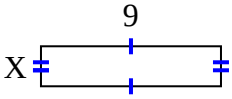

4) area = 16 cm^2

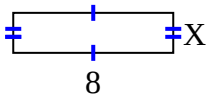

5) area = 8 cm^2

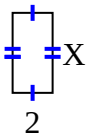

6) area = 56 cm^2

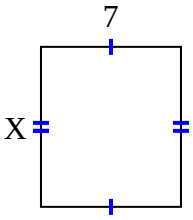

7) area = 63 cm^2

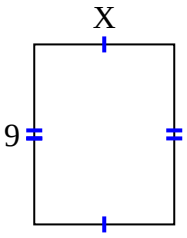

8) area = 81 cm^2

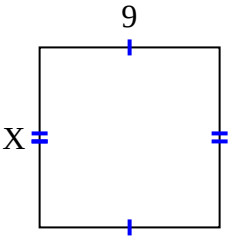

9) area = 20 cm^2

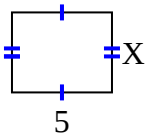

10) area = 14 cm^2

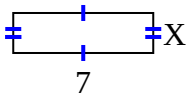

11) area = 9 cm^2

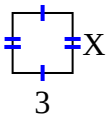

12) area = 54 cm^2

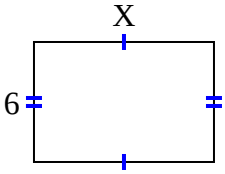

13) area = 16 cm^2

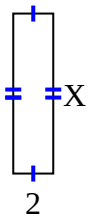

14) area = 15 cm^2

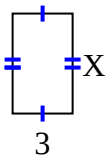

15) area = 49 cm^2

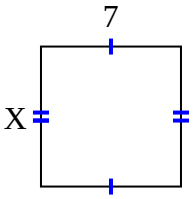

Respuestas

1. 4
2. 6
3. 2
4. 2
5. 4
6. 8
7. 7
8. 9
9. 4
10. 2
11. 3
12. 9
13. 8
14. 5
15. 7

1-10	93	87	80	73	67	60	53	47	40	33
11-15	27	20	13	7	0					