Encuentra la longitud del lado faltante del triángulo rectángulo (área) Nombre:

SPANISH_INSTRUCTIONS

1) perímetro = 22.2 u

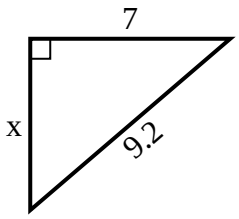

2) perímetro = 22.2 u

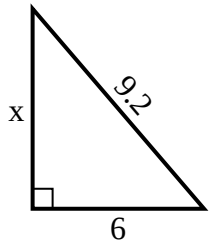

3) perímetro = 25.6 u

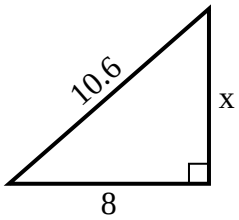

4) perímetro = 20.6 u

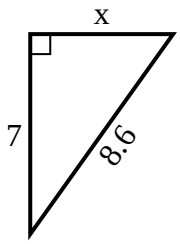

5) perímetro = 27.4 u

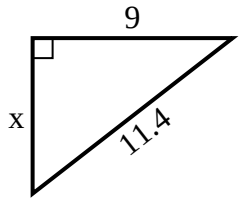

6) perímetro = 15.4 u

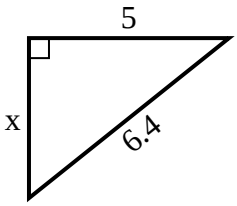

7) perímetro = 20.6 u

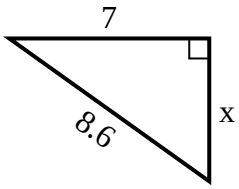

8) perímetro = 6.8 u

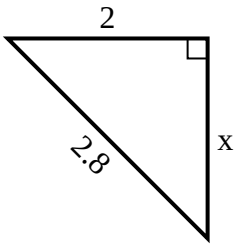

9) perímetro = 8.6 u

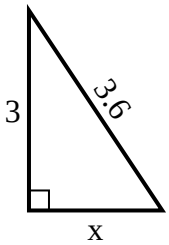

10) perímetro = 25.8 u

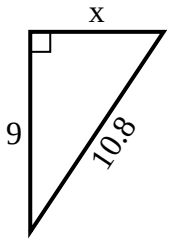

11) perímetro = 8.6 u

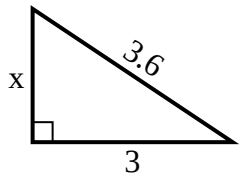

12) perímetro = 19.5 u

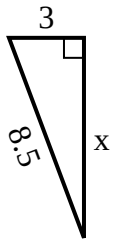

Respuestas

1. _____
2. _____
3. _____
4. _____
5. _____
6. _____
7. _____
8. _____
9. _____
10. _____
11. _____
12. _____

Encuentra la longitud del lado faltante del triángulo rectángulo (área) Nombre: **Clave De Respuestas**

SPANISH_INSTRUCTIONS

1) perímetro = 22.2 u

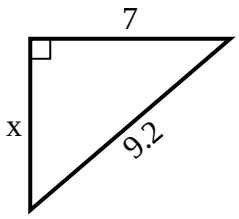

2) perímetro = 22.2 u

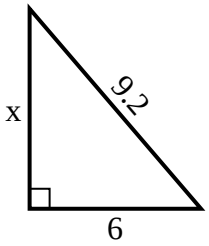

3) perímetro = 25.6 u

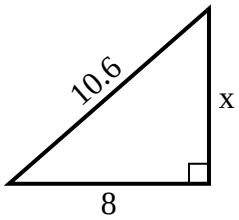

4) perímetro = 20.6 u

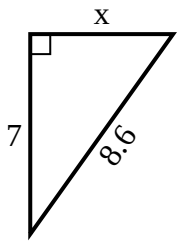

5) perímetro = 27.4 u

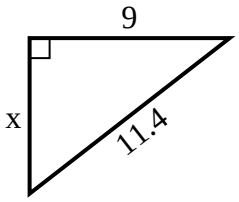

6) perímetro = 15.4 u

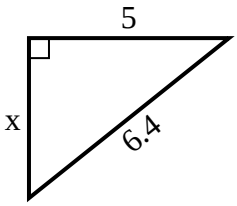

7) perímetro = 20.6 u

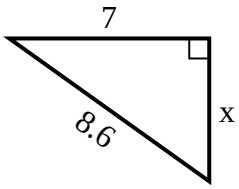

8) perímetro = 6.8 u

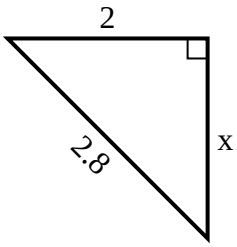

9) perímetro = 8.6 u

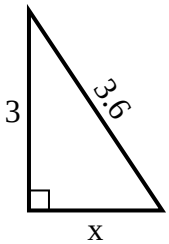

10) perímetro = 25.8 u

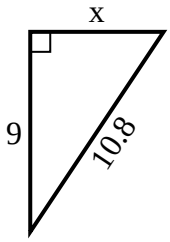

11) perímetro = 8.6 u

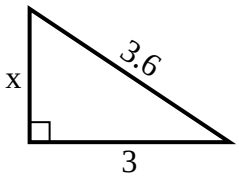

12) perímetro = 19.5 u

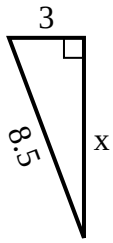

Respuestas

1. 6
2. 7
3. 7
4. 5
5. 7
6. 4
7. 5
8. 2
9. 2
10. 6
11. 2
12. 8

1-10	92	83	75	67	58	50	42	33	25	17
11-12	8	0								