Encontrar los ángulos en las figuras Nombre:

Cuenta el número de ángulos Agudos, Obtusos y Rectos dentro de cada figura

Ej)

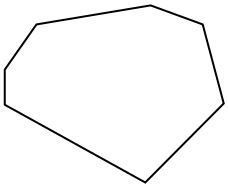

1)

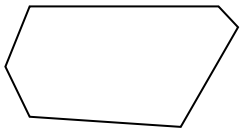

2)

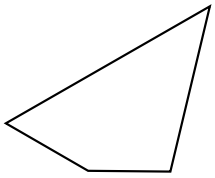

3)

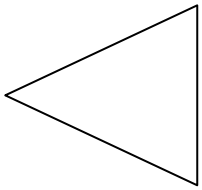

4)



5)

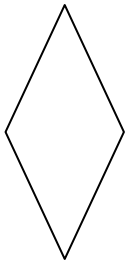

6)



7)

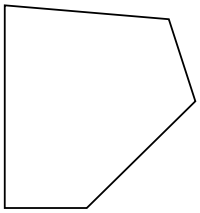

8)

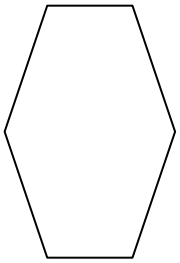

9)



10)

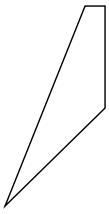

11)

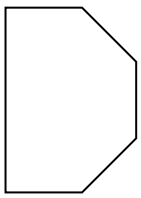

Respuestas

Ej.	0	7	0
1.			
2.			
3.			
4.			
5.			
6.			
7.			
8.			
9.			
10.			
11.			

1-10	91	82	73	64	55	45	36	27	18	9
11	0									

Encontrar los ángulos en las figuras

Nombre: **Clave De Respuestas**

Cuenta el número de ángulos Agudos, Obtusos y Rectos dentro de cada figura

Ej)

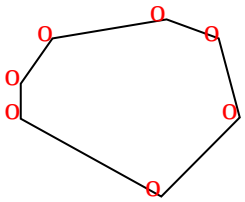

1)

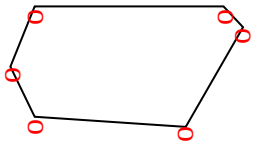

2)

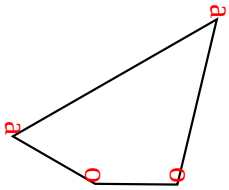

3)

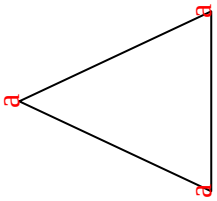

4)



5)

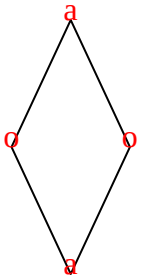

6)

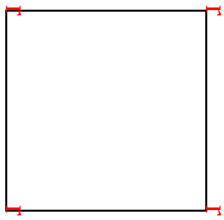

7)

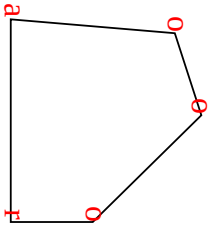

8)

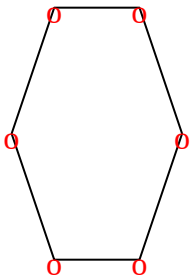

9)

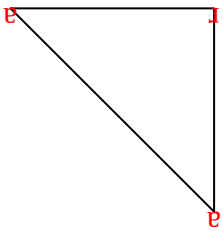

10)

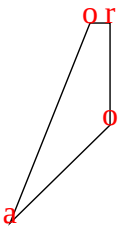

11)

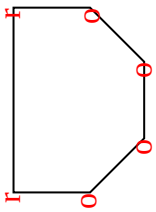

Respuestas

Ej.	0	7	0
1.	0	6	0
2.	2	2	0
3.	3	0	0
4.	0	0	4
5.	2	2	0
6.	0	0	4
7.	1	3	1
8.	0	6	0
9.	2	0	1
10.	1	2	1
11.	0	4	2

1-10	91	82	73	64	55	45	36	27	18	9
11	0									