Completar y emparejar ecuaciones de volumen Nombre:

Empareje cada problema con la ecuación que podría representarlo. Responda con el término y la letra que faltan.

Ej) 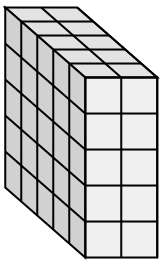

1) 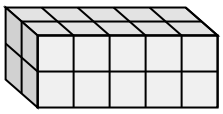

2) 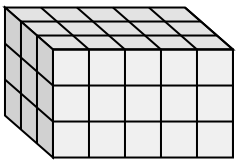

3) 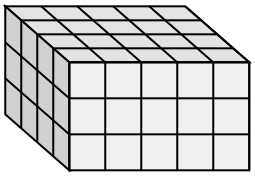

4) 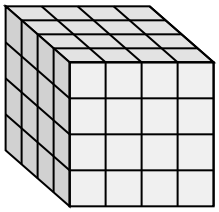

5) 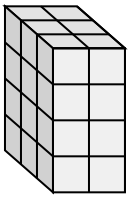

6) 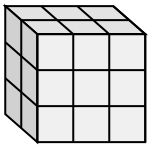

7) 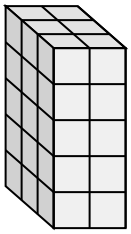

8) 

9) 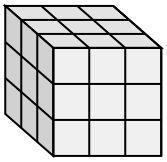

10) 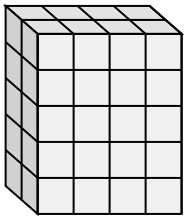

11) 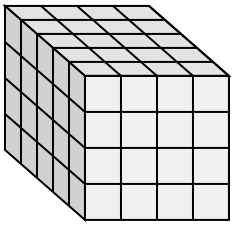

A. ___ × 2 × 5 = 30

B. ___ × 5 × 3 = 60

C. 3 × 3 × ___ = 27

D. 3 × 2 × ___ = 24

E. ___ × 4 × 5 = 100

F. 5 × ___ × 5 = 50

G. ___ × 4 × 4 = 64

H. 3 × 5 × ___ = 45

I. 2 × 5 × 2 = ___

J. ___ × 4 × 4 = 80

K. ___ × 3 × 3 = 18

L. 2 × 4 × ___ = 40

Respuestas

Ej. F , 2

1. _____

2. _____

3. _____

4. _____

5. _____

6. _____

7. _____

8. _____

9. _____

10. _____

11. _____

1-10	91	82	73	64	55	45	36	27	18	9
11	0									

Completar y emparejar ecuaciones de volumen

Nombre: **Clave De Respuestas**

Empareje cada problema con la ecuación que podría representarlo. Responda con el término y la letra que faltan.

Ej) 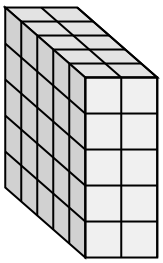

1) 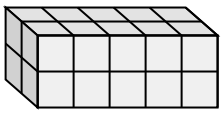

2) 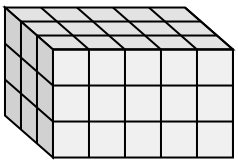

3) 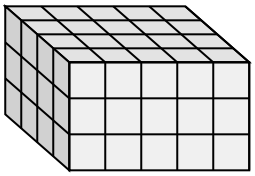

4) 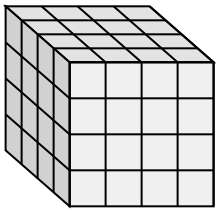

5) 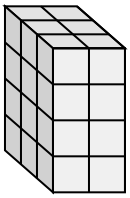

6) 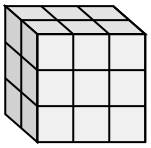

7) 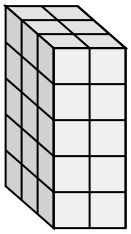

8) 

9) 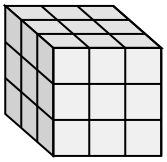

10) 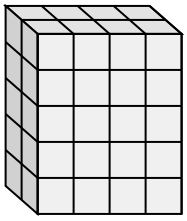

11) 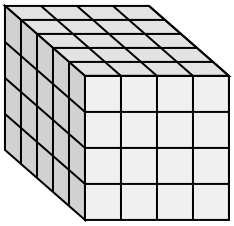

A. ___ × 2 × 5 = 30

B. ___ × 5 × 3 = 60

C. 3 × 3 × ___ = 27

D. 3 × 2 × ___ = 24

E. ___ × 4 × 5 = 100

F. 5 × ___ × 5 = 50

G. ___ × 4 × 4 = 64

H. 3 × 5 × ___ = 45

I. 2 × 5 × 2 = ___

J. ___ × 4 × 4 = 80

K. ___ × 3 × 3 = 18

L. 2 × 4 × ___ = 40

Respuestas

Ej. F , 2

1. I , 20
2. H , 3
3. B , 4
4. G , 4
5. D , 4
6. K , 2
7. A , 3
8. E , 5
9. C , 3
10. L , 5
11. J , 5

1-10	91	82	73	64	55	45	36	27	18	9
11	0									