Identifica el volumen de una caja Nombre:

Determina el volumen de cada caja. Cada bloque es de una unidad cúbica (u^3).

1)

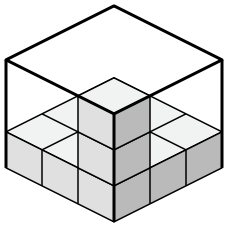

2)

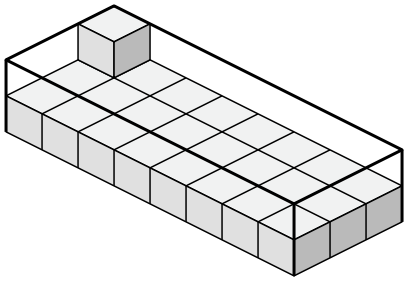

3)

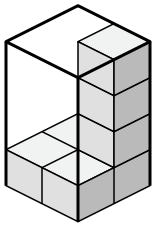

4)

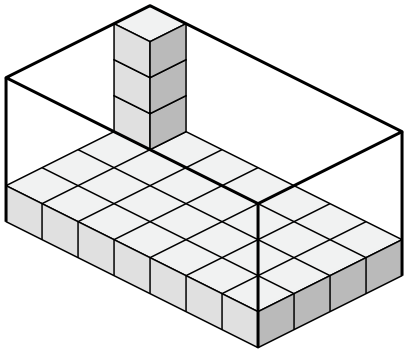

5)

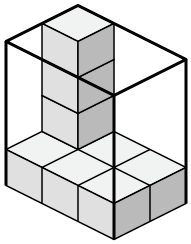

6)

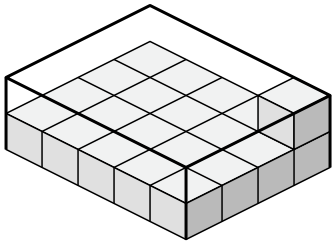

7)

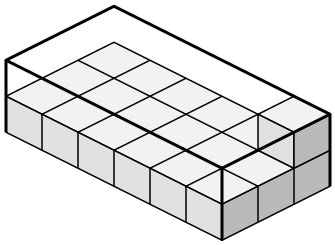

8)

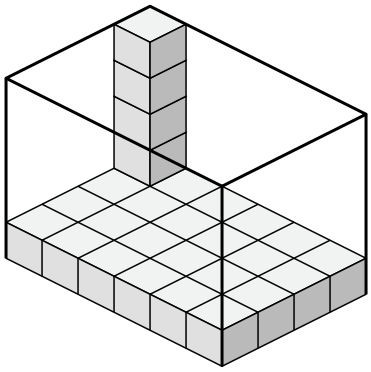

Respuestas

1. _____
2. _____
3. _____
4. _____
5. _____
6. _____
7. _____
8. _____

1-8	88	75	63	50	38	25	13	0

Identifica el volumen de una caja

Nombre: **Clave De Respuestas**

Determina el volumen de cada caja. Cada bloque es de una unidad cúbica (u^3).

1)

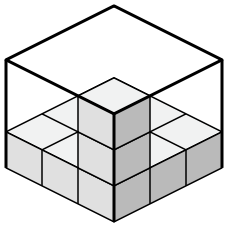

2)

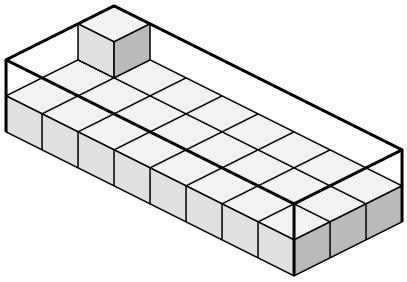

3)

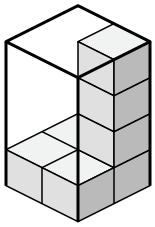

4)

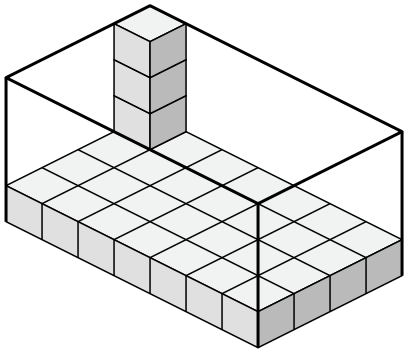

5)

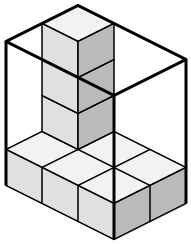

6)

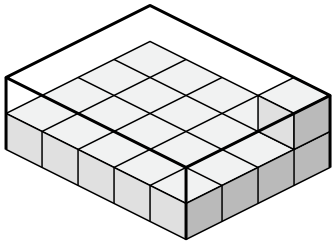

7)

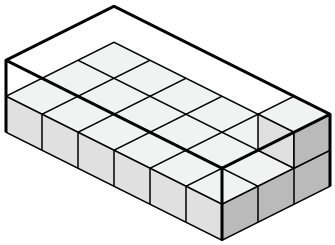

8)

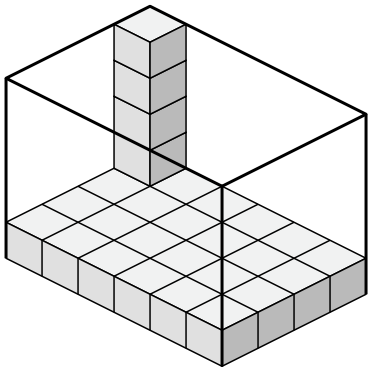

Respuestas

1. **27 u^3**
2. **48 u^3**
3. **16 u^3**
4. **112 u^3**
5. **24 u^3**
6. **40 u^3**
7. **36 u^3**
8. **120 u^3**

1-8	88	75	63	50	38	25	13	0