Encuentra el área de los triángulos. Nombre:

Encuentra el área de cada triángulo. Redondea tu respuesta a la décima más cercana.

1)

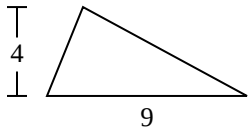

2)

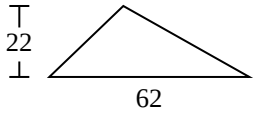

3)

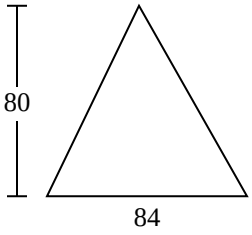

4)

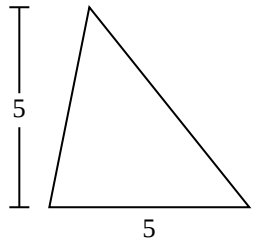

5)

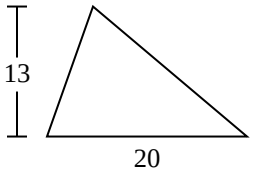

6)

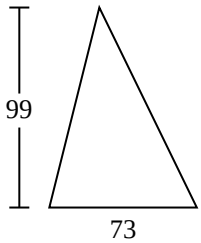

7)

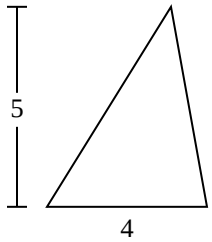

8)

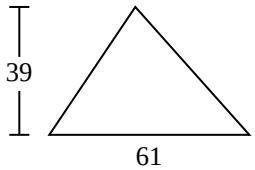

9)

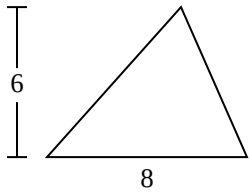

10)

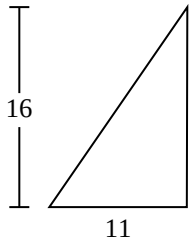

Respuestas

1. _____
2. _____
3. _____
4. _____
5. _____
6. _____
7. _____
8. _____
9. _____
10. _____

1-10	90	80	70	60	50	40	30	20	10	0

Encuentra el área de los triángulos. Nombre: **Clave De Respuestas**

Encuentra el área de cada triángulo. Redondea tu respuesta a la décima más cercana.

1)

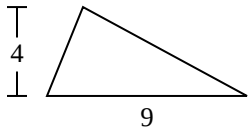

2)

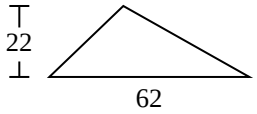

3)

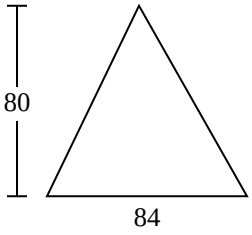

4)

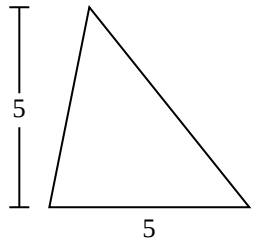

5)

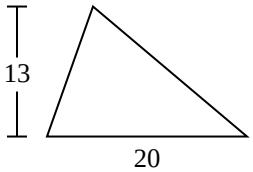

6)

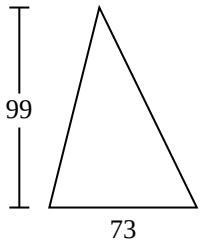

7)

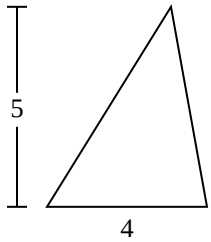

8)

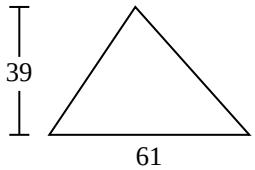

9)

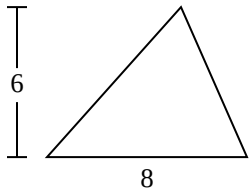

10)

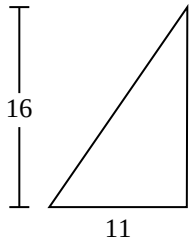

Respuestas

1. **18**
2. **682**
3. **3,360**
4. **12.5**
5. **130**
6. **3,613.5**
7. **10**
8. **1,189.5**
9. **24**
10. **88**

1-10	90	80	70	60	50	40	30	20	10	0

Encuentra el área de los triángulos. Nombre:

Encuentra el área de cada triángulo. Redondea tu respuesta a la décima más cercana.

10	3,613.5	18	24	3,360
1,189.5	130	12.5	682	

1)

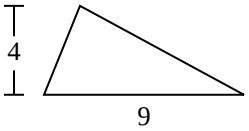

2)

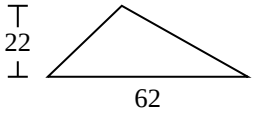

3)

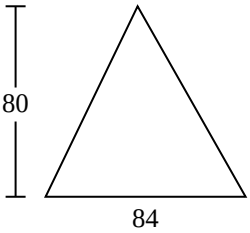

4)

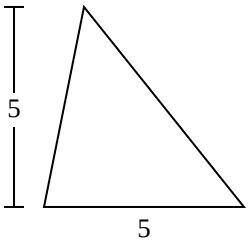

5)

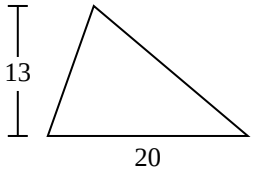

6)

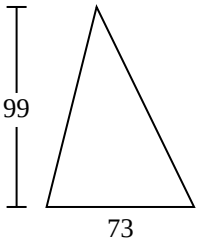

7)

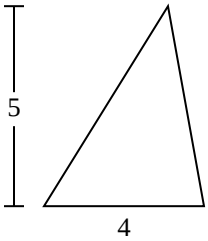

8)

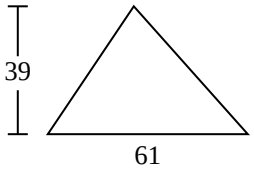

9)

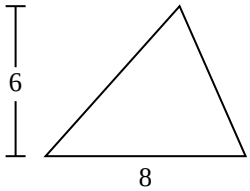

Respuestas

1. _____
2. _____
3. _____
4. _____
5. _____
6. _____
7. _____
8. _____
9. _____