Encuentra la longitud del lado faltante de un rectángulo con fracciones Nombre:

**Encuentra el valor de X de cada figura. Cada figura está en centímetros (cm). No a escala.**

**1)** area = $^{24}/_{36}$ cm$^2$

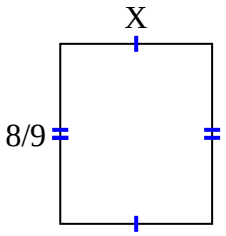


**2)** area = $^{16}/_{30}$ cm$^2$

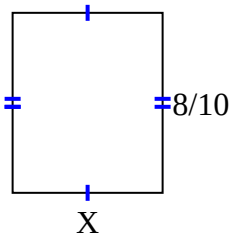


**3)** area = $^{10}/_{27}$ cm$^2$

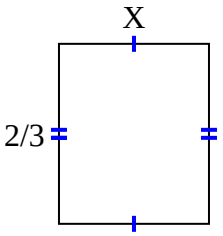


**4)** area = $^{42}/_{90}$ cm$^2$

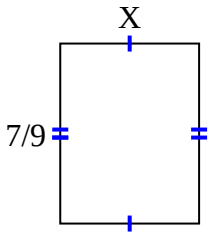


**5)** area = $^{7}/_{63}$ cm$^2$

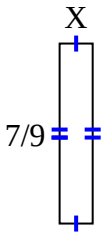


**6)** area = $^{16}/_{40}$ cm$^2$

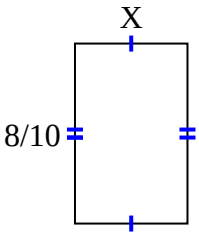


**7)** area = $^{4}/_{10}$ cm$^2$

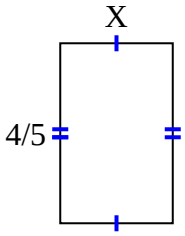


**8)** area = $^{16}/_{40}$ cm$^2$

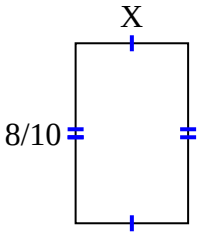


**9)** area = $^{4}/_{21}$ cm$^2$

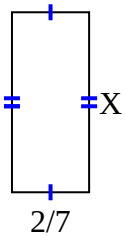


**10)** area = $^{3}/_{24}$ cm$^2$

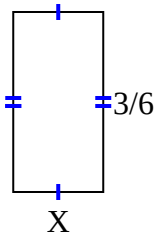


**11)** area = $^{4}/_{28}$ cm$^2$

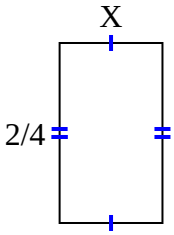


**12)** area = $^{4}/_{24}$ cm$^2$

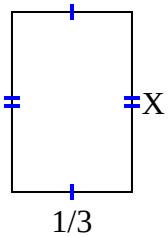


**Respuestas**

1. _____
2. _____
3. _____
4. _____
5. _____
6. _____
7. _____
8. _____
9. _____
10. _____
11. _____
12. _____

**Encuentra el valor de X de cada figura. Cada figura está en centímetros (cm). No a escala.**

**1)** area = $^{24}/_{36}$ cm$^2$

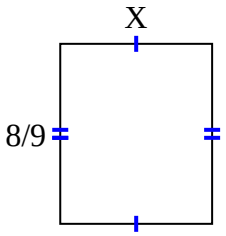


**2)** area = $^{16}/_{30}$ cm$^2$

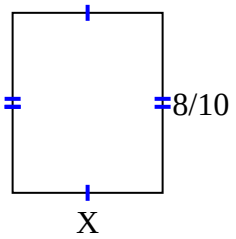


**3)** area = $^{10}/_{27}$ cm$^2$

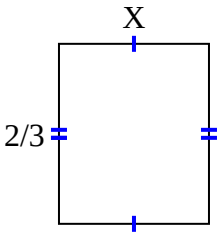


**4)** area = $^{42}/_{90}$ cm$^2$

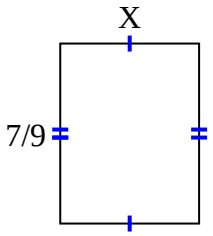


**5)** area = $^{7}/_{63}$ cm$^2$

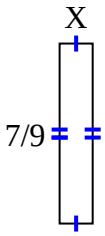


**6)** area = $^{16}/_{40}$ cm$^2$

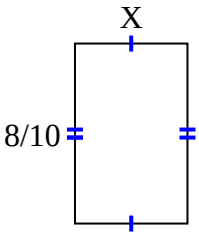


**7)** area = $^{4}/_{10}$ cm$^2$

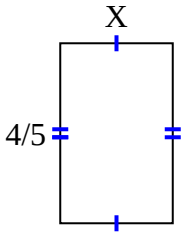


**8)** area = $^{16}/_{40}$ cm$^2$

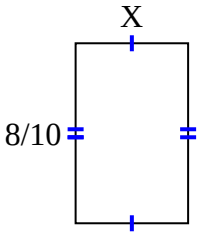


**9)** area = $^{4}/_{21}$ cm$^2$

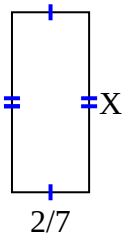


**10)** area = $^{3}/_{24}$ cm$^2$

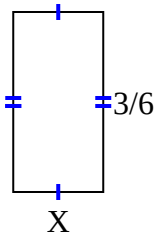


**11)** area = $^{4}/_{28}$ cm$^2$

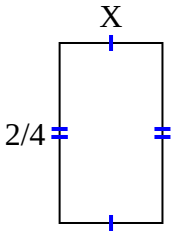


**12)** area = $^{4}/_{24}$ cm$^2$

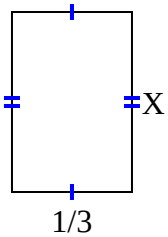


## Respuestas

1. $^{3}/_{4}$
2. $^{2}/_{3}$
3. $^{5}/_{9}$
4. $^{6}/_{10}$
5. $^{1}/_{7}$
6. $^{2}/_{4}$
7. $^{1}/_{2}$
8. $^{2}/_{4}$
9. $^{2}/_{3}$
10. $^{1}/_{4}$
11. $^{2}/_{7}$
12. $^{4}/_{8}$



| | | | | | | | | | | |
|---|---|---|---|---|---|---|---|---|---|---|
| 1-10 | 92 | 83 | 75 | 67 | 58 | 50 | 42 | 33 | 25 | 17 |
| 11-12 | 8 | 0 | | | | | | | | |