Encontrando la longitud de los lados (dada el área) Nombre:

Determina el valor de 'P'.

1) Área = $72u^2$

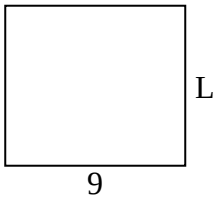

2) Área = $20u^2$

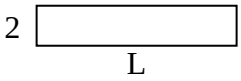

3) Área = $70u^2$

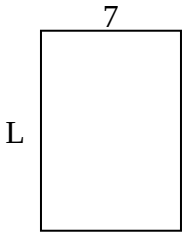

4) Área = $45u^2$

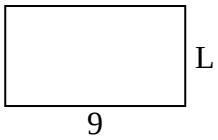

5) Área = $20u^2$



6) Área = $15u^2$

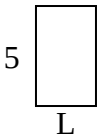

7) Área = $54u^2$

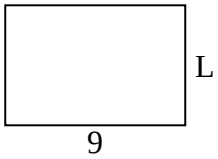

8) Área = $40u^2$

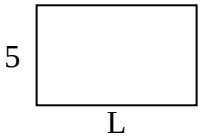

9) Área = $20u^2$

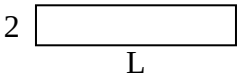

10) Área = $15u^2$

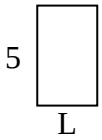

11) Área = $45u^2$



12) Área = $30u^2$

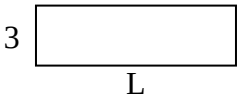

13) Área = $42u^2$

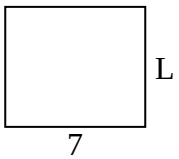

14) Área = $12u^2$

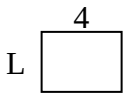

15) Área = $24u^2$

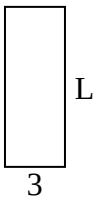

Respuestas

1. _____
2. _____
3. _____
4. _____
5. _____
6. _____
7. _____
8. _____
9. _____
10. _____
11. _____
12. _____
13. _____
14. _____
15. _____

1-10	93	87	80	73	67	60	53	47	40	33
11-15	27	20	13	7	0					

Encontrando la longitud de los lados (dada el área) Nombre: **Clave De Respuestas**

Determina el valor de 'P'.

1) Área = $72u^2$

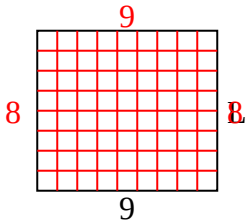

2) Área = $20u^2$

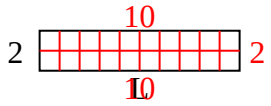

3) Área = $70u^2$

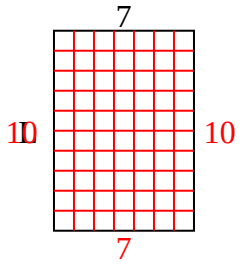

4) Área = $45u^2$

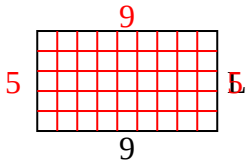

5) Área = $20u^2$

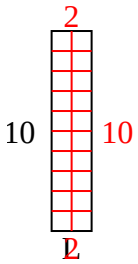

6) Área = $15u^2$

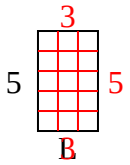

7) Área = $54u^2$

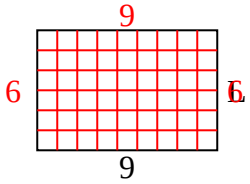

8) Área = $40u^2$

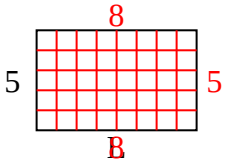

9) Área = $20u^2$

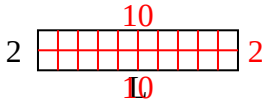

10) Área = $15u^2$

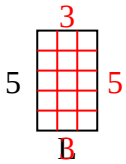

11) Área = $45u^2$

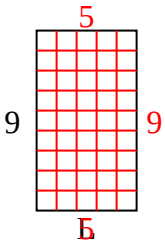

12) Área = $30u^2$

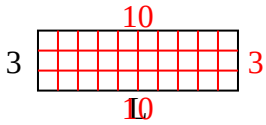

13) Área = $42u^2$

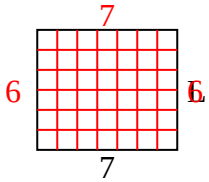

14) Área = $12u^2$

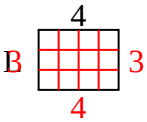

15) Área = $24u^2$

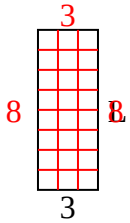

Respuestas

1. **8**
2. **10**
3. **10**
4. **5**
5. **2**
6. **3**
7. **6**
8. **8**
9. **10**
10. **3**
11. **5**
12. **10**
13. **6**
14. **3**
15. **8**