Contar formas

Nombre:

Cuente el número de formas que se muestran.

1) 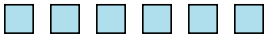

2)

3)

4) 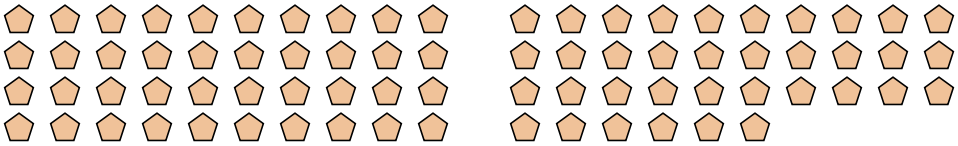

5) 

Respuestas

1. _____

2. _____

3. _____

4. _____

5. _____

1-5	80	60	40	20	0

Contar formas

Nombre: **Clave De Respuestas**

Cuente el número de formas que se muestran.

1) 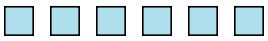

2)

3)

4) 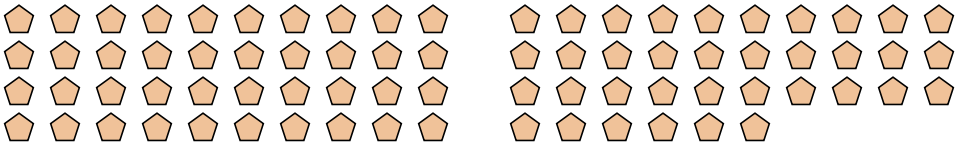

5) 

Respuestas

1. **6**
2. **51**
3. **31**
4. **76**
5. **103**

1-5	80	60	40	20	0