Sumar decimales con una recta numérica Nombre:

Use la recta numérica para resolver cada problema.

1) 4.6 + 2.5 =

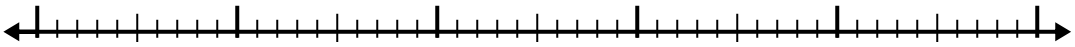

2) 2.8 + 1.7 =

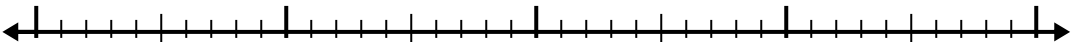

3) 4.2 + 2.5 =

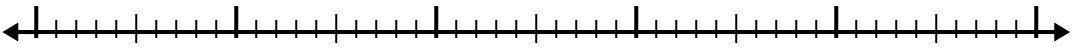

4) 5.1 + 3.7 =

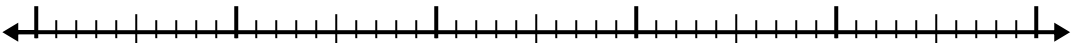

5) 8.3 + 1.2 =

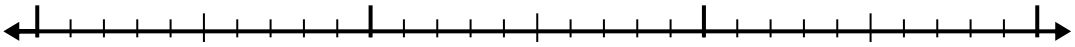

6) 3.3 + 3.9 =



7) 8.4 + 1.1 =

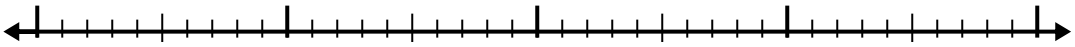

8) 8.2 + 1.8 =

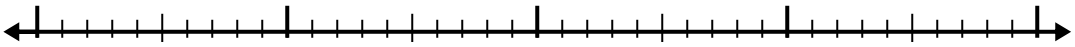

9) 8.7 + 2.3 =

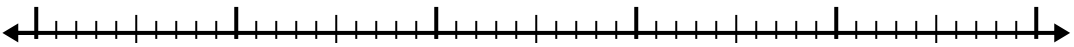

10) 6.5 + 3.2 =

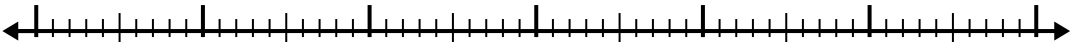

Respuestas

1. _____
2. _____
3. _____
4. _____
5. _____
6. _____
7. _____
8. _____
9. _____
10. _____

1-10	90	80	70	60	50	40	30	20	10	0

Sumar decimales con una recta numérica

Nombre: **Clave De Respuestas**

Use la recta numérica para resolver cada problema.

1) 4.6 + 2.5 =

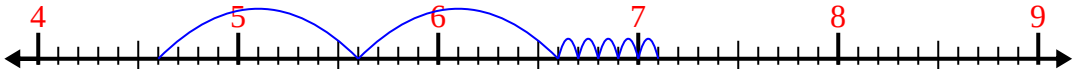

2) 2.8 + 1.7 =

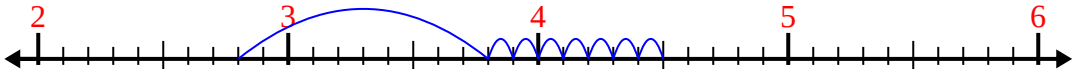

3) 4.2 + 2.5 =

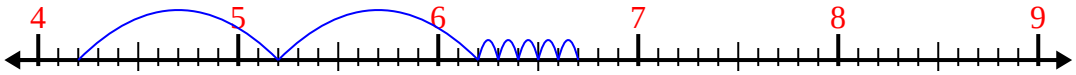

4) 5.1 + 3.7 =

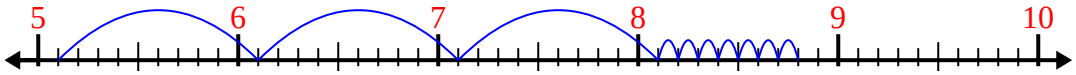

5) 8.3 + 1.2 =

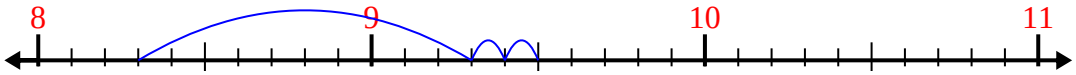

6) 3.3 + 3.9 =

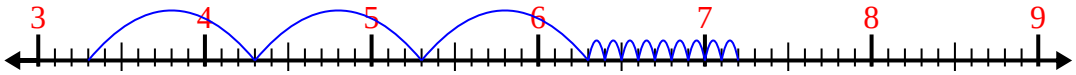

7) 8.4 + 1.1 =

8) 8.2 + 1.8 =

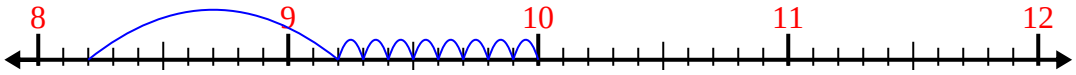

9) 8.7 + 2.3 =

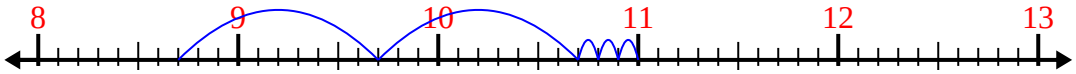

10) 6.5 + 3.2 =

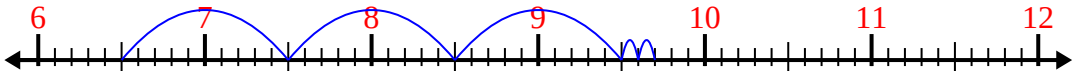

Respuestas

1. **7.1**
2. **4.5**
3. **6.7**
4. **8.8**
5. **9.5**
6. **7.2**
7. **9.5**
8. **10.0**
9. **11.0**
10. **9.7**

1-10	90	80	70	60	50	40	30	20	10	0