Determinación del valor decimal con bloques

Nombre:

Utilice el bloque de la izquierda para encontrar el valor del conjunto de bloques de la derecha.

1) 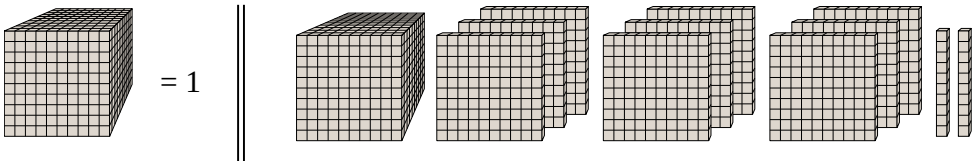

2) 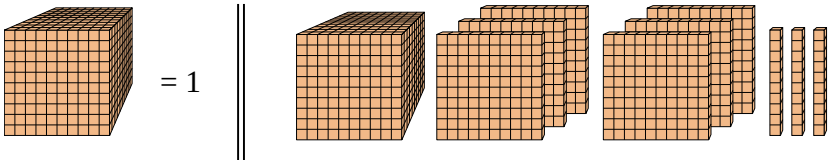

3) 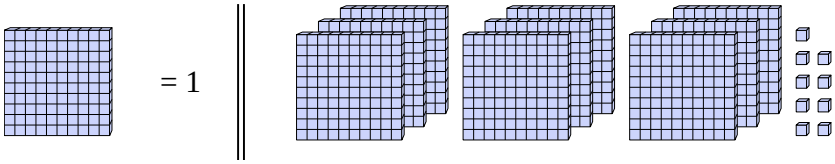

4) 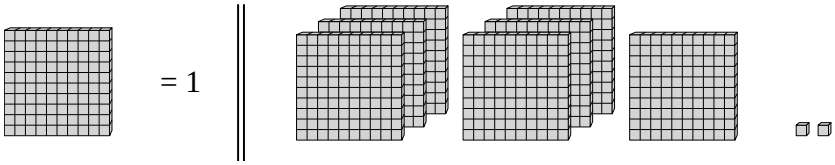

5) 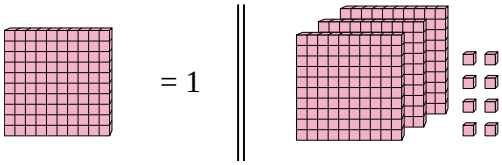

6) 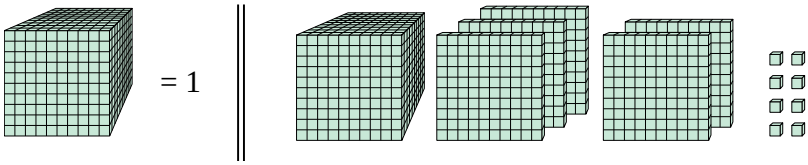

7) 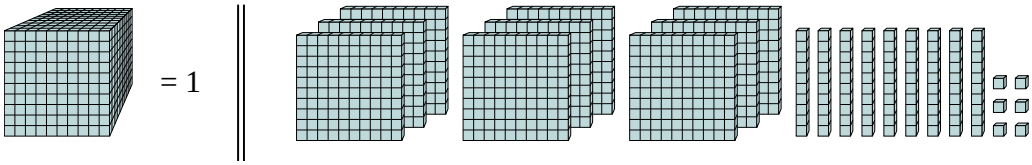

8) 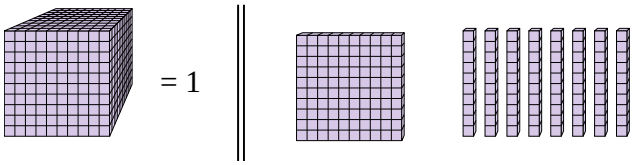

9) 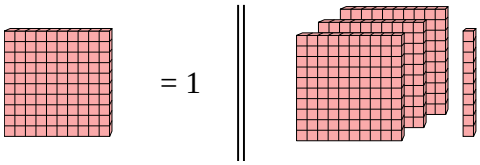

10) 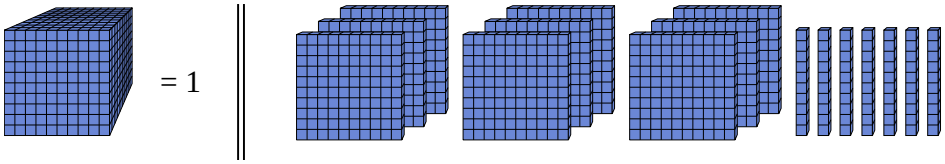

Respuestas

1. _____
2. _____
3. _____
4. _____
5. _____
6. _____
7. _____
8. _____
9. _____
10. _____

1-10	90	80	70	60	50	40	30	20	10	0

Determinación del valor decimal con bloques Nombre: **Clave De Respuestas**

Utilice el bloque de la izquierda para encontrar el valor del conjunto de bloques de la derecha.

1) 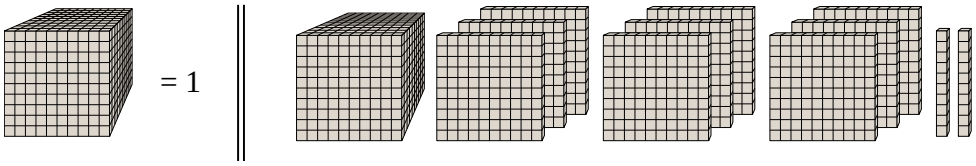

2) 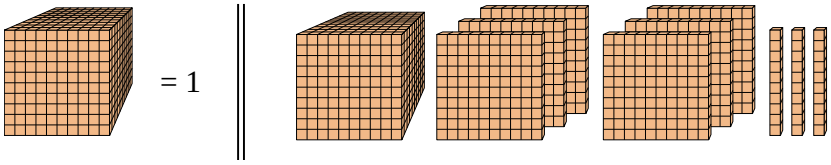

3) 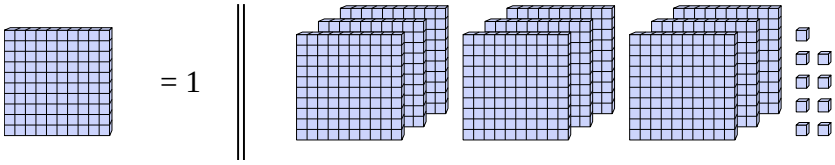

4) 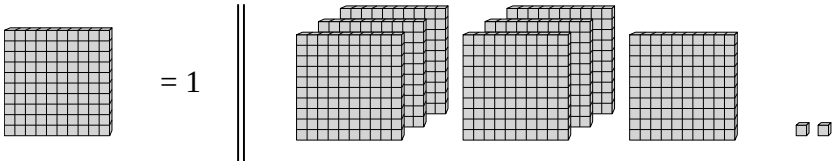

5) 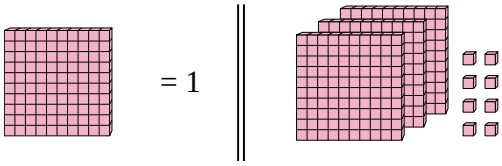

6) 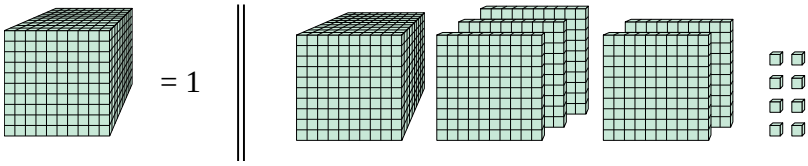

7) 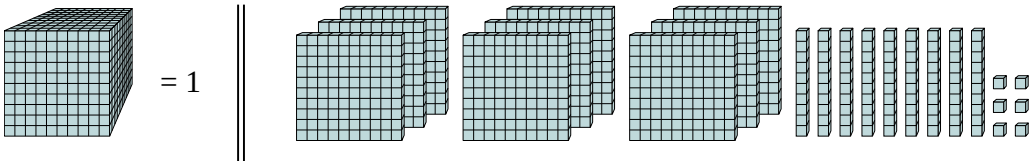

8) 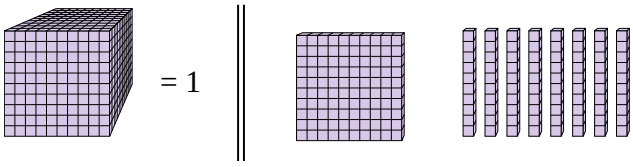

9) 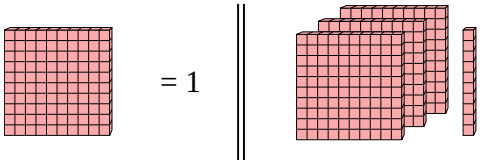

10) 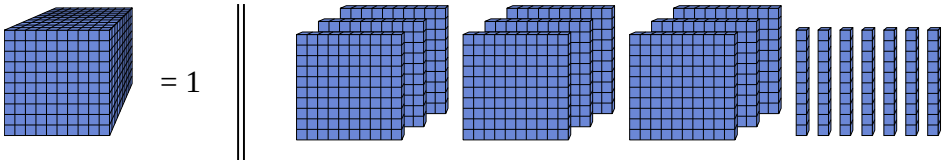

Respuestas

1. **1.92**
2. **1.63**
3. **9.09**
4. **7.02**
5. **3.08**
6. **1.508**
7. **0.996**
8. **0.18**
9. **3.1**
10. **0.97**

1-10	90	80	70	60	50	40	30	20	10	0