Determinación del valor decimal con bloques

Nombre:

Utilice el bloque de la izquierda para encontrar el valor del conjunto de bloques de la derecha.

1) 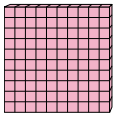 = 1 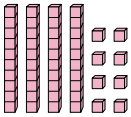

2)  = 1 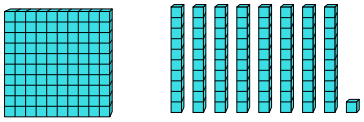

3) 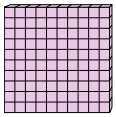 = 1 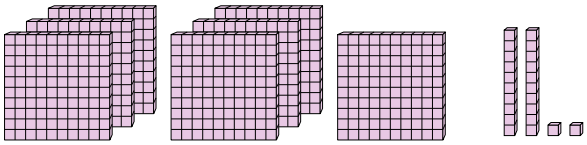

4)  = 1 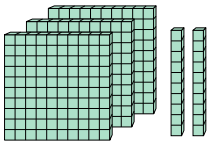

5) 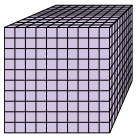 = 1 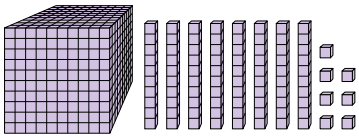

6) 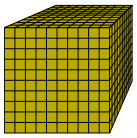 = 1 

7) 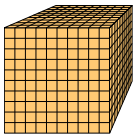 = 1 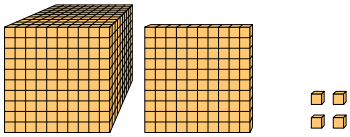

8) 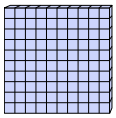 = 1 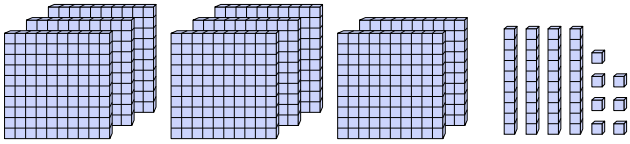

9) 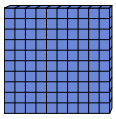 = 1 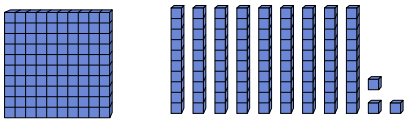

10) 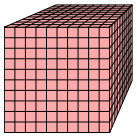 = 1 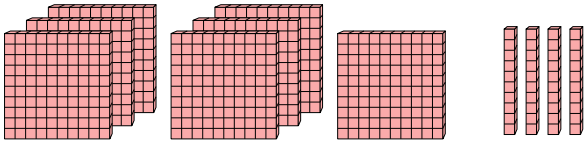

Respuestas

1. _____
2. _____
3. _____
4. _____
5. _____
6. _____
7. _____
8. _____
9. _____
10. _____

1-10	90	80	70	60	50	40	30	20	10	0

Determinación del valor decimal con bloques

Nombre: **Clave De Respuestas**

Utilice el bloque de la izquierda para encontrar el valor del conjunto de bloques de la derecha.

1) 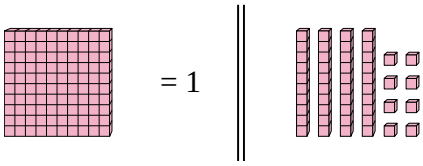

2) 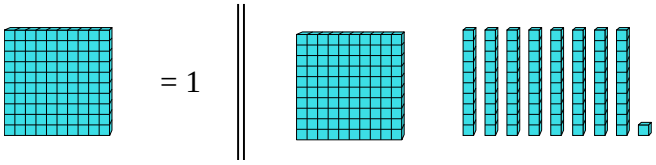

3) 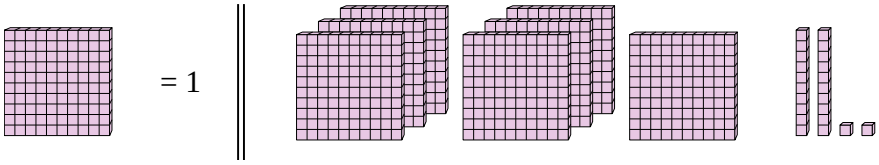

4) 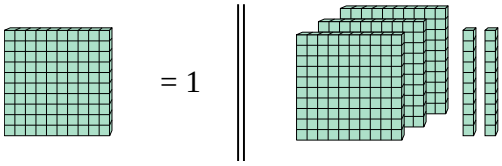

5) 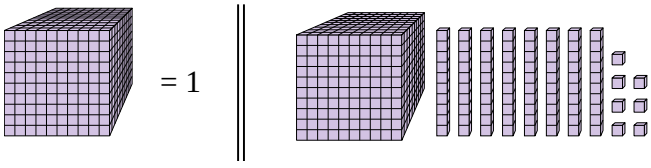

6) 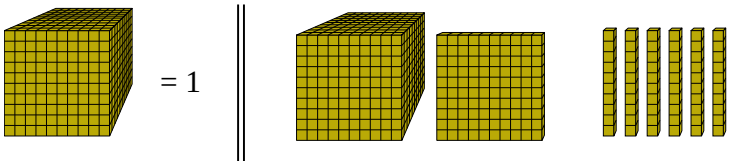

7) 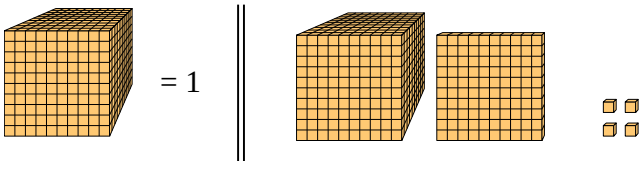

8) 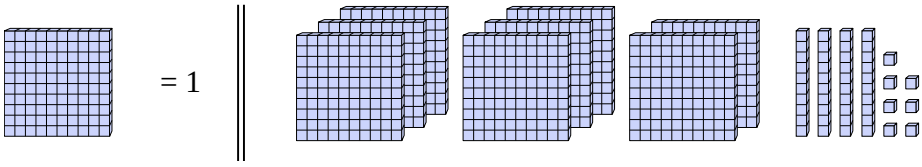

9) 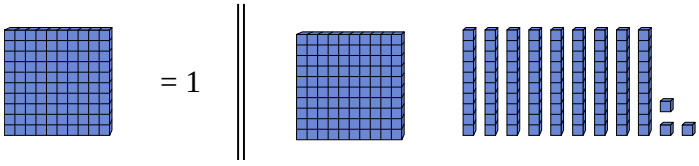

10) 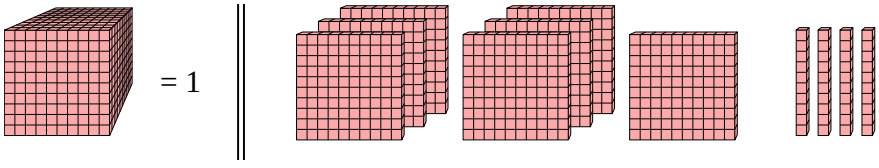

Respuestas

1. **0.48**
2. **1.81**
3. **7.22**
4. **3.2**
5. **1.087**
6. **1.16**
7. **1.104**
8. **8.47**
9. **1.93**
10. **0.74**

1-10	90	80	70	60	50	40	30	20	10	0

Determinación del valor decimal con bloques

Nombre:

Utilice el bloque de la izquierda para encontrar el valor del conjunto de bloques de la derecha.

1) 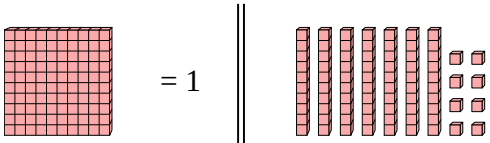

2) 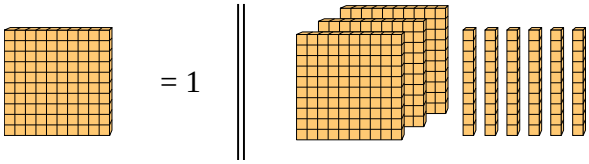

3) 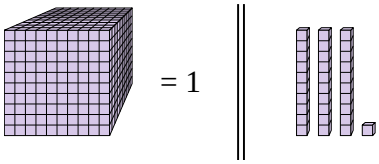

4) 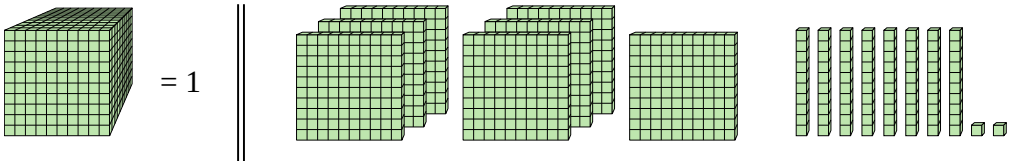

5) 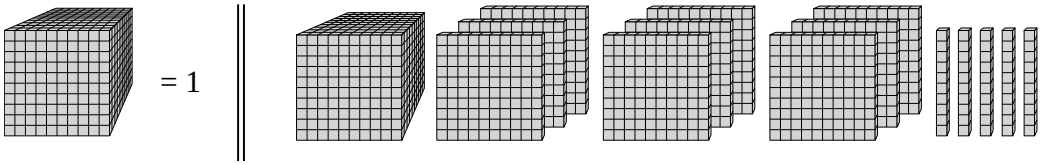

6) 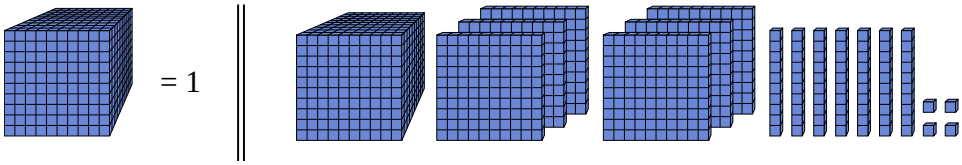

7) 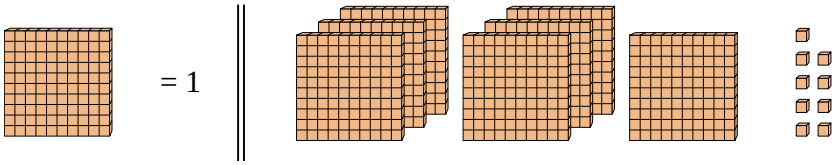

8) 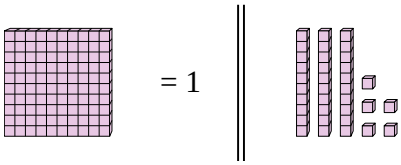

9) 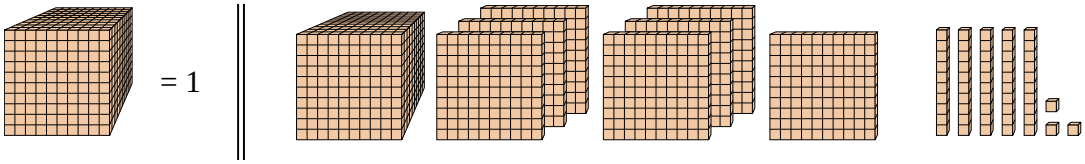

10) 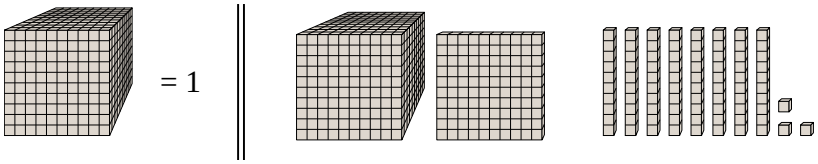

Respuestas

1. _____
2. _____
3. _____
4. _____
5. _____
6. _____
7. _____
8. _____
9. _____
10. _____

1-10	90	80	70	60	50	40	30	20	10	0

Utilice el bloque de la izquierda para encontrar el valor del conjunto de bloques de la derecha.

1) 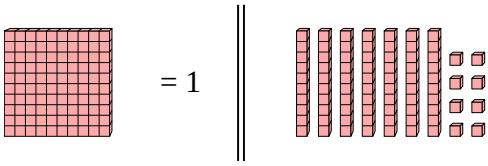

2) 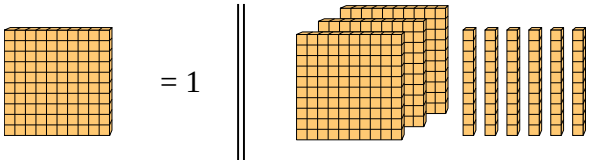

3) 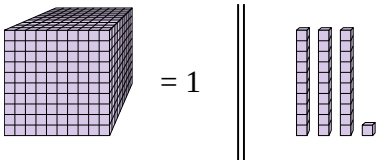

4) 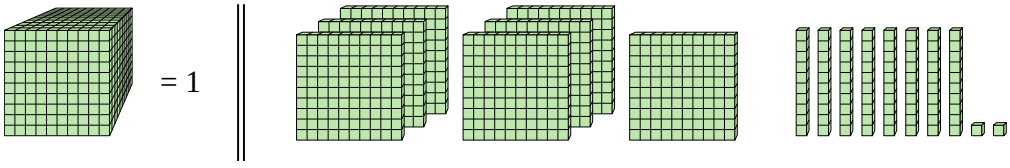

5) 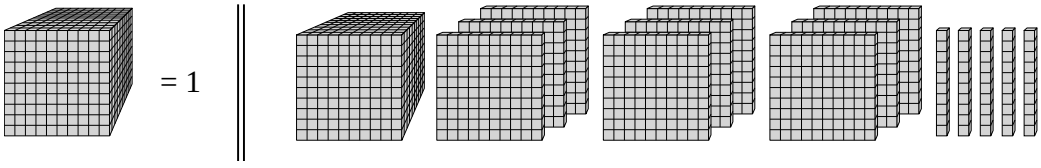

6) 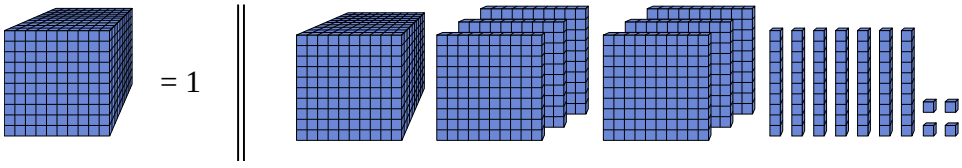

7) 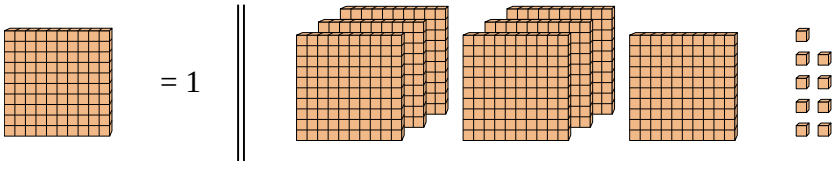

8) 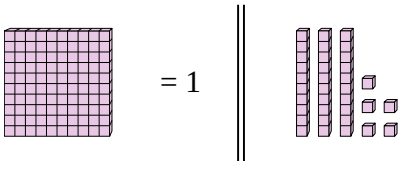

9) 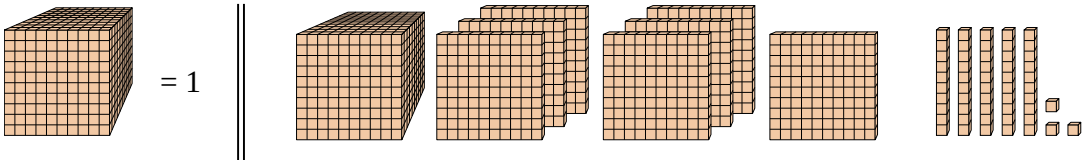

10) 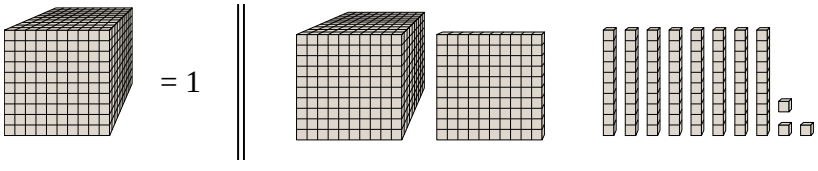

Respuestas

1. **0.78**
2. **3.6**
3. **0.031**
4. **0.782**
5. **1.95**
6. **1.674**
7. **7.09**
8. **0.35**
9. **1.753**
10. **1.183**

1-10	90	80	70	60	50	40	30	20	10	0

Determinación del valor decimal con bloques Nombre:

Utilice el bloque de la izquierda para encontrar el valor del conjunto de bloques de la derecha.

1) 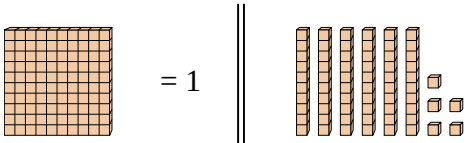

2) 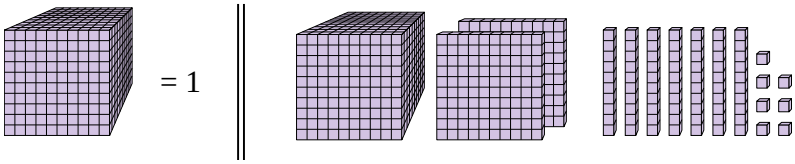

3) 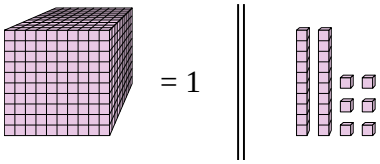

4) 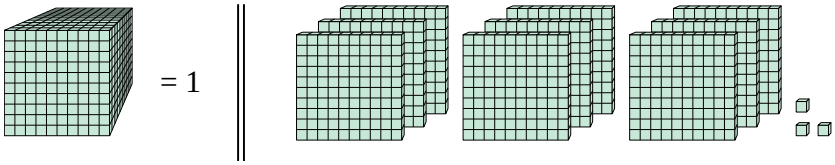

5) 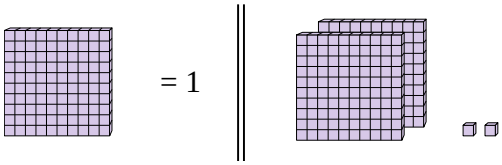

6) 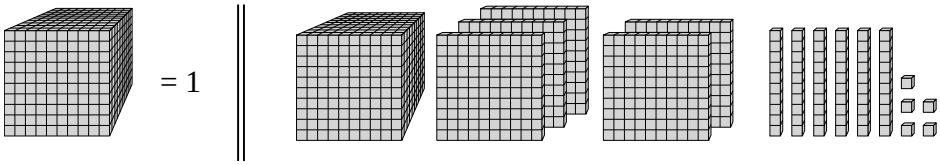

7) 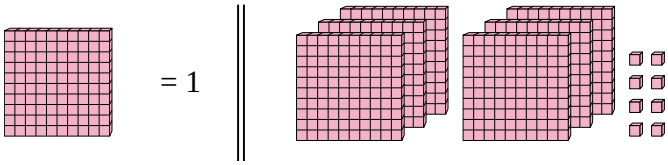

8) 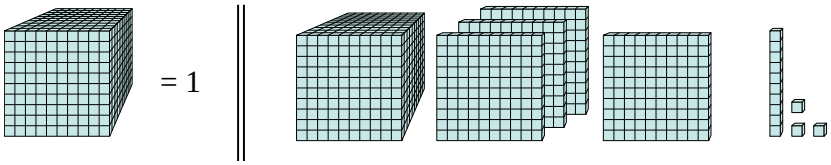

9) 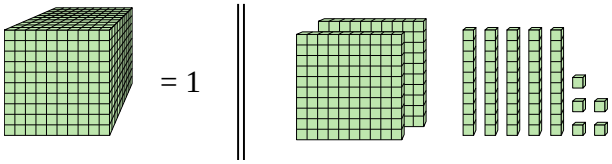

10) 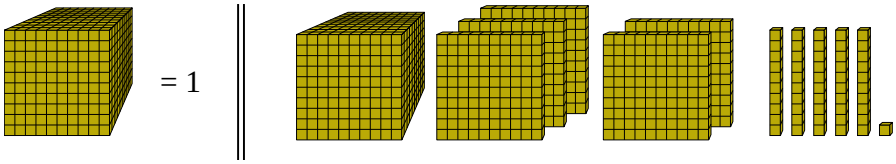

Respuestas

1. _____
2. _____
3. _____
4. _____
5. _____
6. _____
7. _____
8. _____
9. _____
10. _____

1-10	90	80	70	60	50	40	30	20	10	0

Determinación del valor decimal con bloques Nombre: **Clave De Respuestas**

Utilice el bloque de la izquierda para encontrar el valor del conjunto de bloques de la derecha.

1) 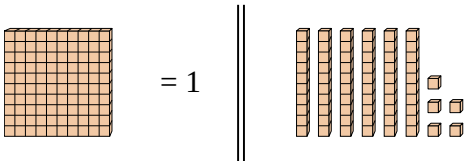

2) 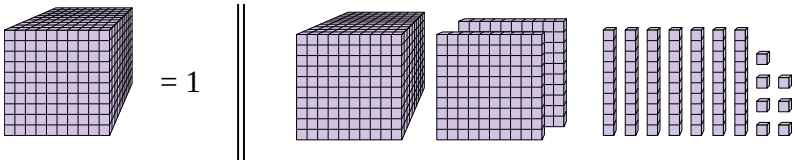

3) 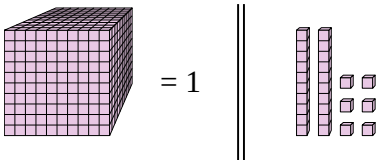

4) 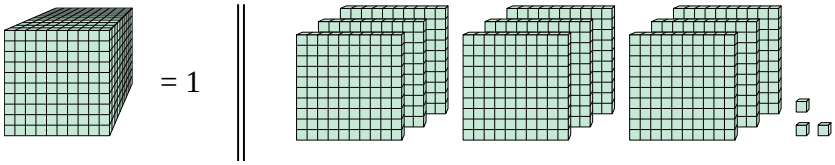

5) 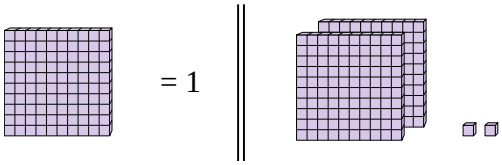

6) 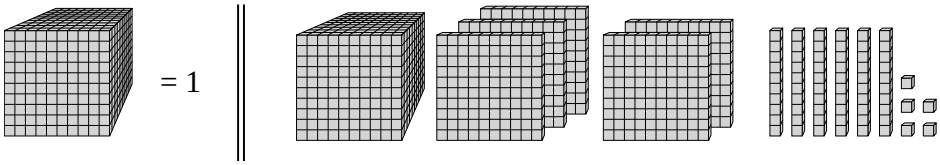

7) 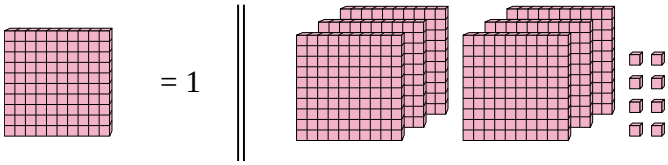

8) 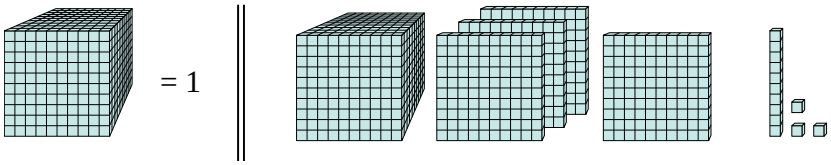

9) 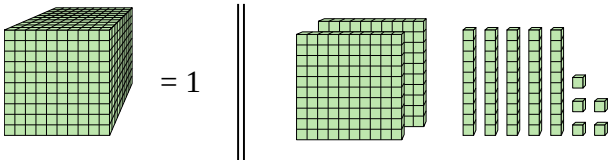

10) 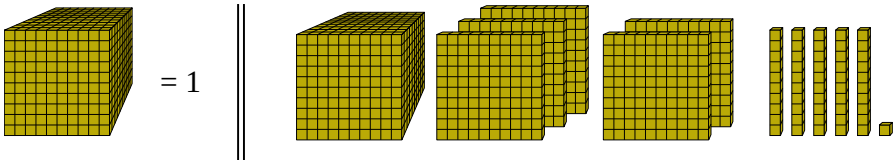

Respuestas

1. **0.65**
2. **1.277**
3. **0.026**
4. **0.903**
5. **2.02**
6. **1.565**
7. **6.08**
8. **1.413**
9. **0.255**
10. **1.551**

1-10	90	80	70	60	50	40	30	20	10	0

Determinación del valor decimal con bloques

Nombre:

Utilice el bloque de la izquierda para encontrar el valor del conjunto de bloques de la derecha.

1)  = 1 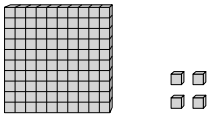

2) 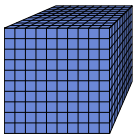 = 1 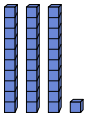

3)  = 1 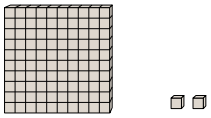

4) 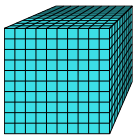 = 1 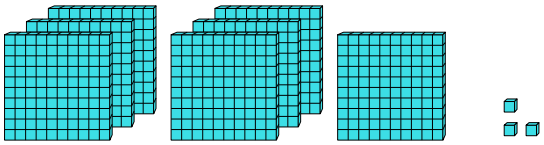

5) 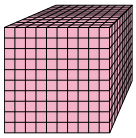 = 1 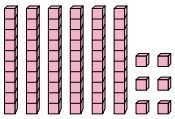

6) 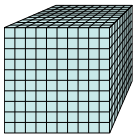 = 1 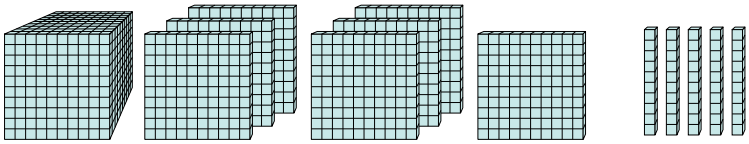

7) 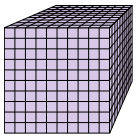 = 1 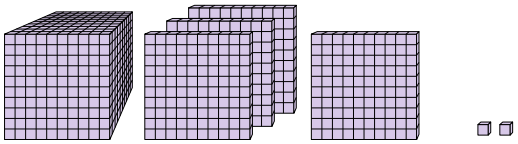

8)  = 1 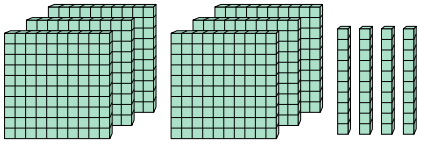

9) 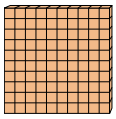 = 1 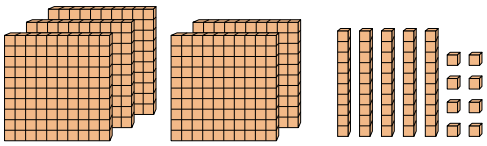

10) 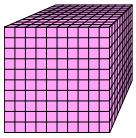 = 1 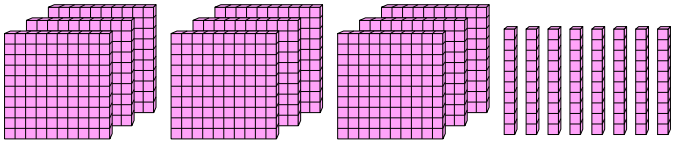

Respuestas

1. _____
2. _____
3. _____
4. _____
5. _____
6. _____
7. _____
8. _____
9. _____
10. _____

1-10	90	80	70	60	50	40	30	20	10	0

Determinación del valor decimal con bloques Nombre: **Clave De Respuestas**

Utilice el bloque de la izquierda para encontrar el valor del conjunto de bloques de la derecha.

1)  = 1 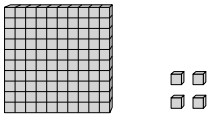

2) 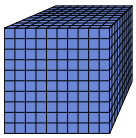 = 1 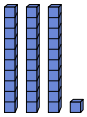

3)  = 1 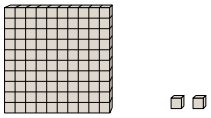

4) 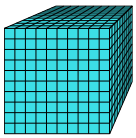 = 1 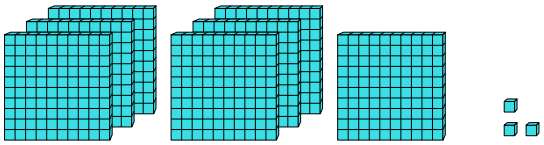

5) 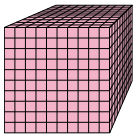 = 1 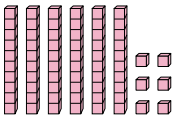

6) 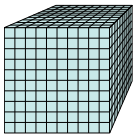 = 1 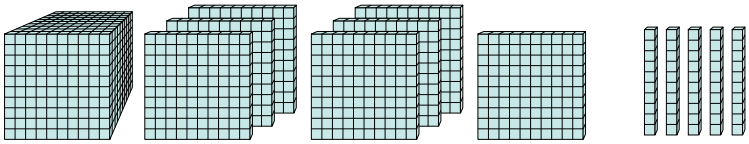

7) 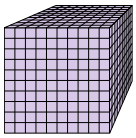 = 1 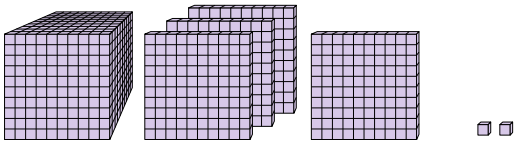

8)  = 1 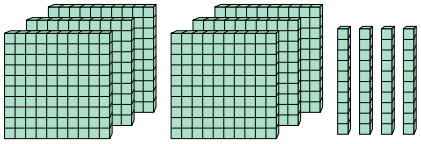

9) 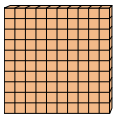 = 1 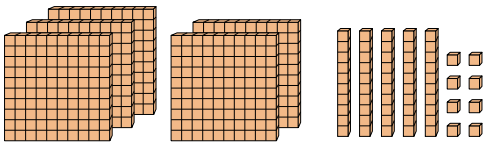

10) 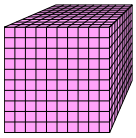 = 1 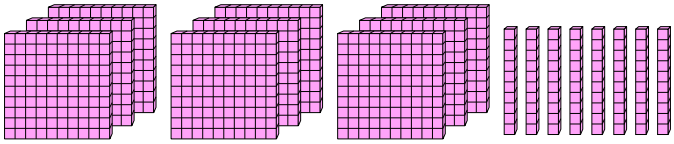

Respuestas

1. **1.04**
2. **0.031**
3. **0.102**
4. **0.703**
5. **0.066**
6. **1.75**
7. **1.402**
8. **6.4**
9. **5.58**
10. **0.98**

1-10	90	80	70	60	50	40	30	20	10	0

Determinación del valor decimal con bloques Nombre:

Utilice el bloque de la izquierda para encontrar el valor del conjunto de bloques de la derecha.

1) 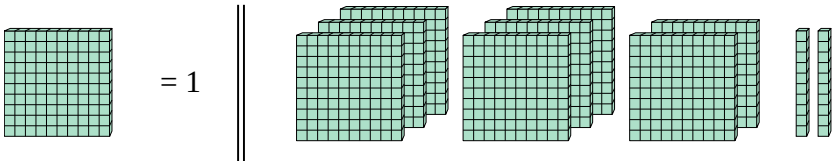

2) 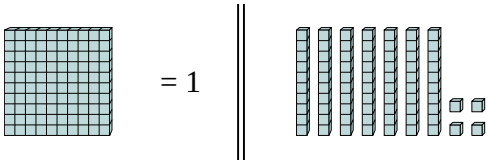

3) 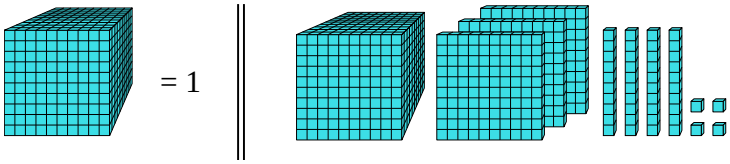

4) 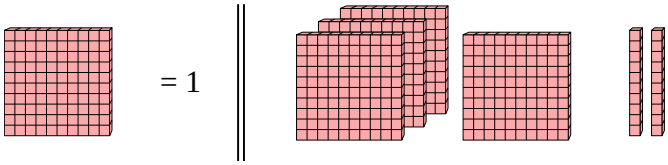

5) 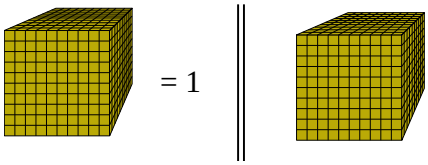

6) 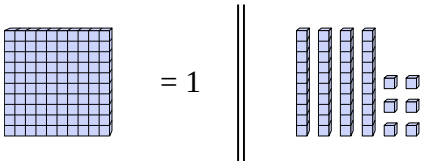

7) 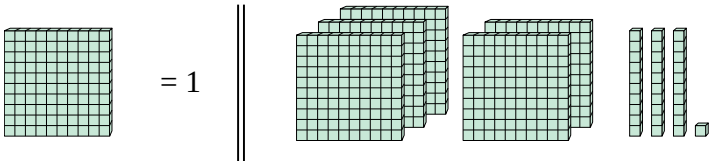

8) 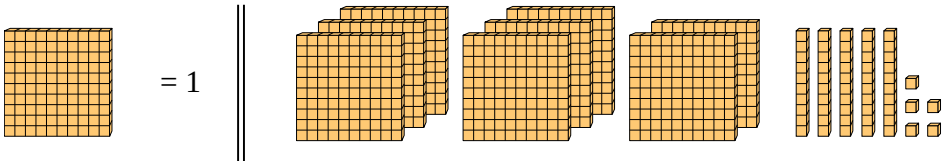

9) 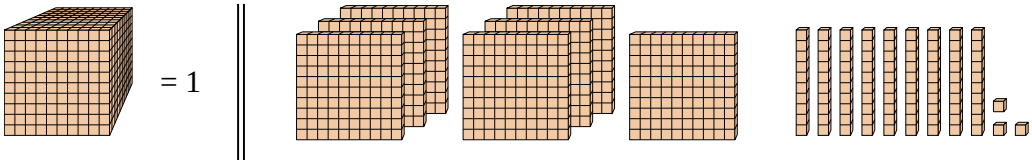

10) 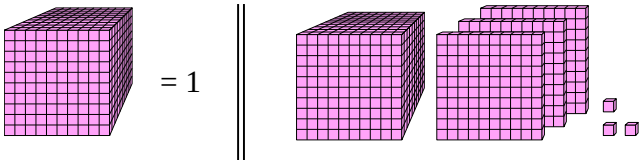

Respuestas

1. _____
2. _____
3. _____
4. _____
5. _____
6. _____
7. _____
8. _____
9. _____
10. _____

1-10	90	80	70	60	50	40	30	20	10	0

Utilice el bloque de la izquierda para encontrar el valor del conjunto de bloques de la derecha.

1) 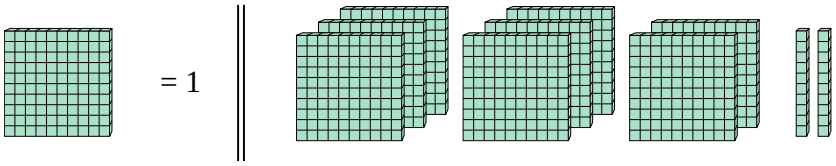

2) 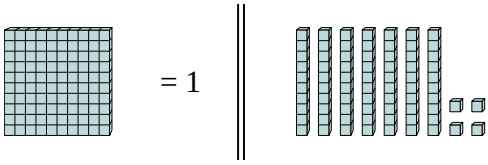

3) 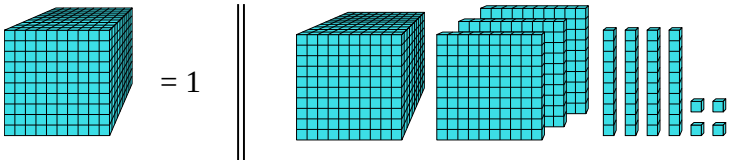

4) 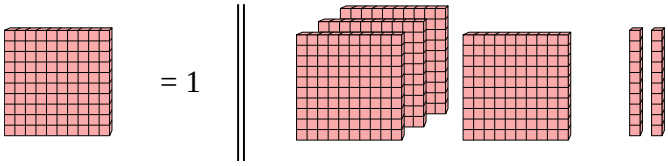

5) 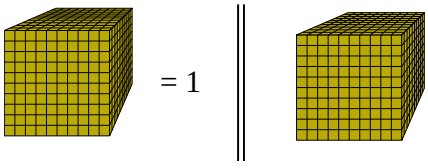

6) 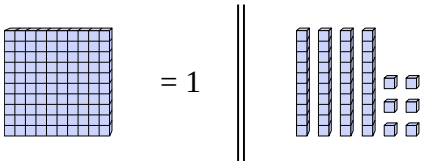

7) 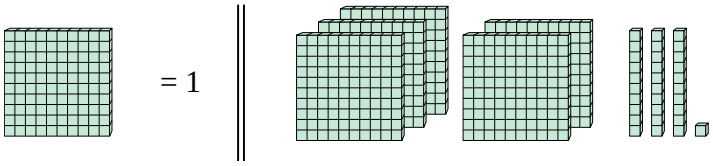

8) 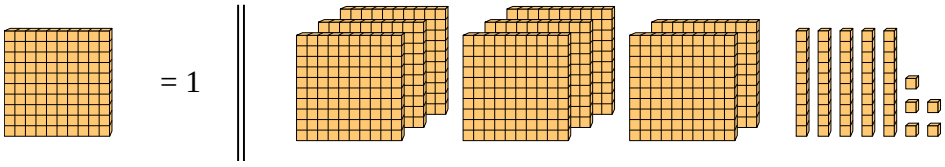

9) 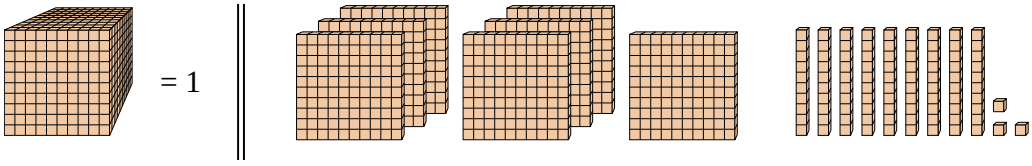

10) 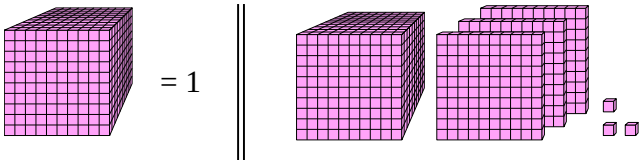

Respuestas

1. **8.2**
2. **0.74**
3. **1.344**
4. **4.2**
5. **1**
6. **0.46**
7. **5.31**
8. **8.55**
9. **0.793**
10. **1.303**

1-10	90	80	70	60	50	40	30	20	10	0

Determinación del valor decimal con bloques Nombre:

Utilice el bloque de la izquierda para encontrar el valor del conjunto de bloques de la derecha.

1) 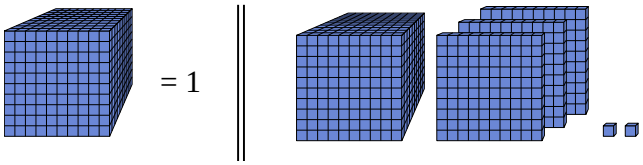

2) 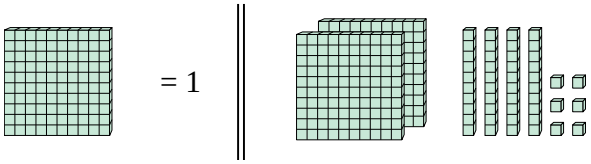

3) 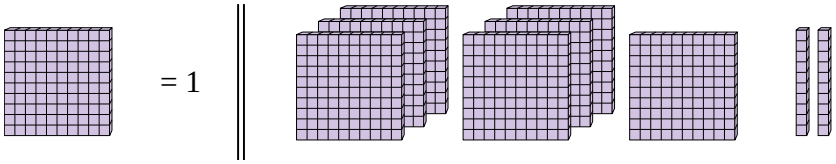

4) 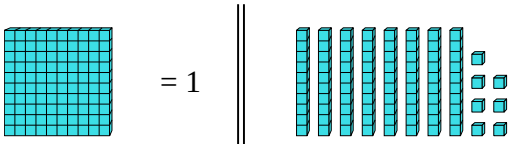

5) 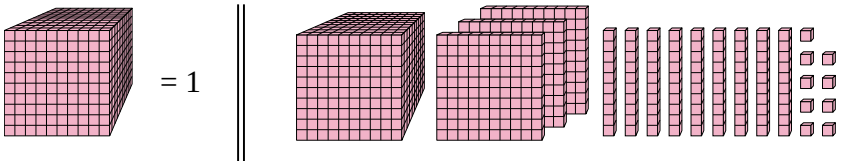

6) 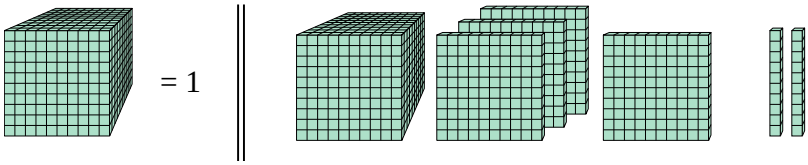

7) 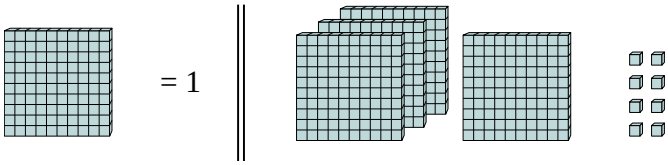

8) 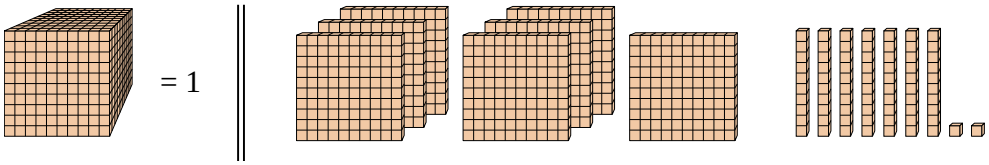

9) 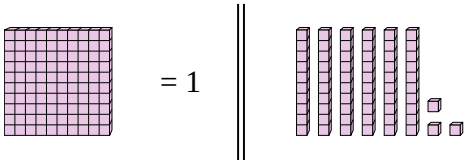

10) 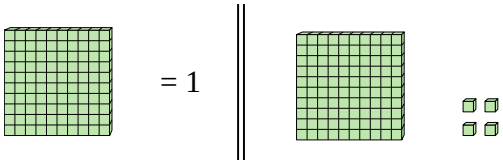

Respuestas

1. _____
2. _____
3. _____
4. _____
5. _____
6. _____
7. _____
8. _____
9. _____
10. _____

1-10	90	80	70	60	50	40	30	20	10	0

Determinación del valor decimal con bloques

Nombre: **Clave De Respuestas**

Utilice el bloque de la izquierda para encontrar el valor del conjunto de bloques de la derecha.

1) 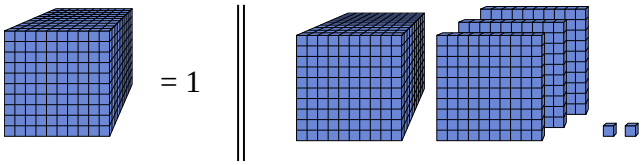

2) 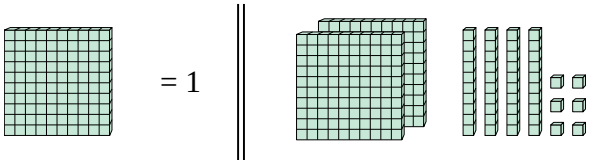

3) 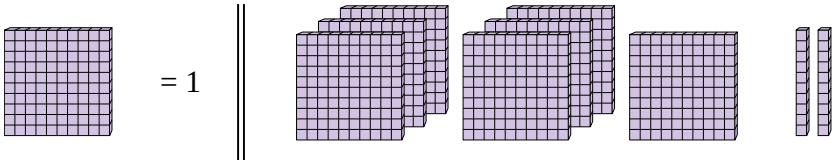

4) 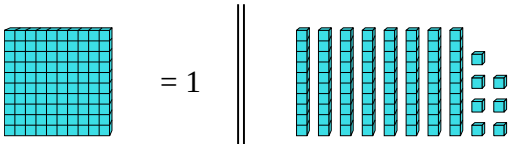

5) 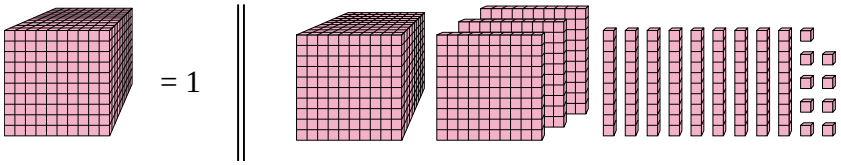

6) 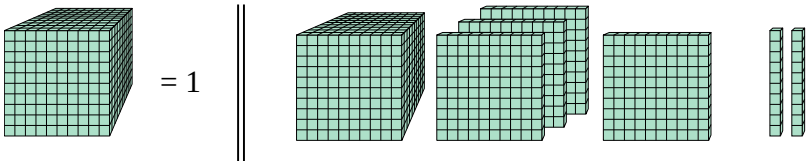

7) 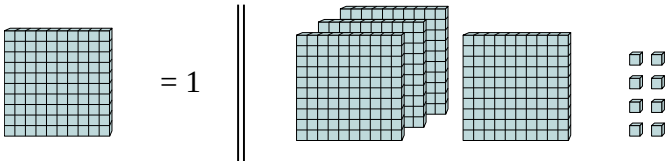

8) 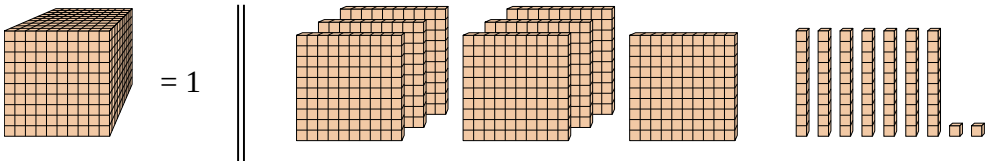

9) 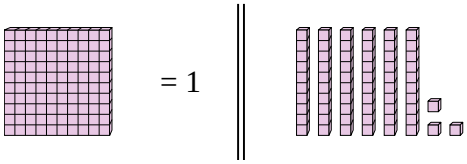

10) 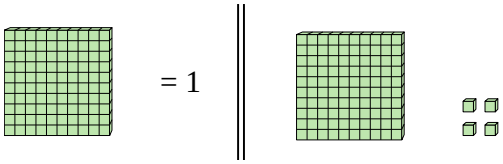

Respuestas

1. **1.302**
2. **2.46**
3. **7.2**
4. **0.87**
5. **1.399**
6. **1.42**
7. **4.08**
8. **0.772**
9. **0.63**
10. **1.04**

1-10	90	80	70	60	50	40	30	20	10	0

Determinación del valor decimal con bloques

Nombre:

Utilice el bloque de la izquierda para encontrar el valor del conjunto de bloques de la derecha.

1) 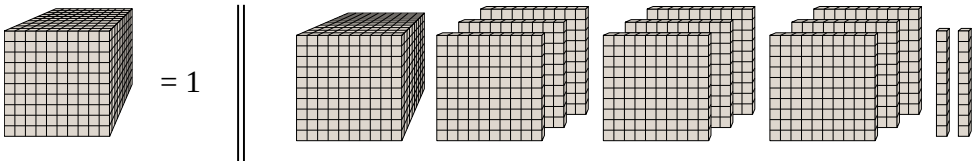

2) 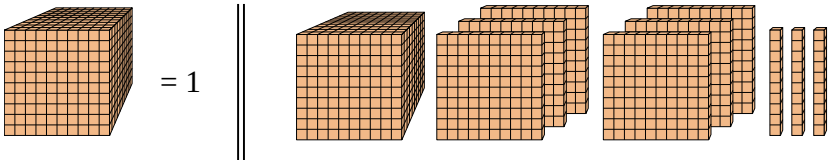

3) 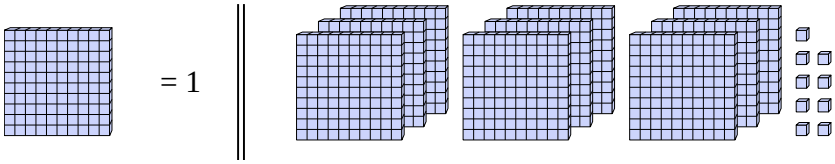

4) 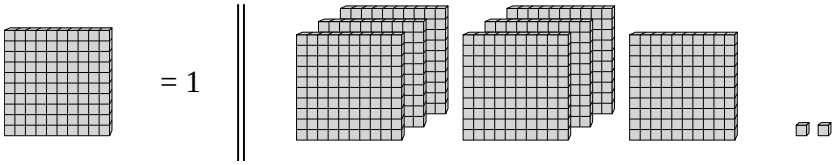

5) 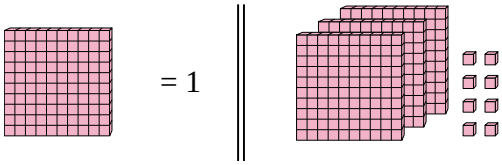

6) 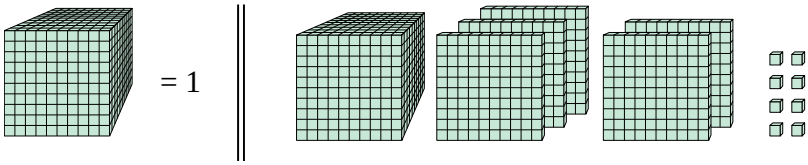

7) 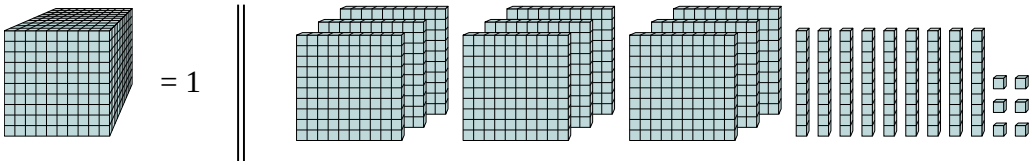

8) 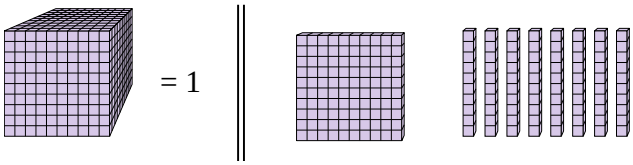

9) 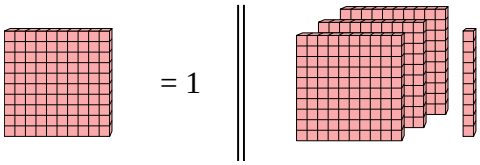

10) 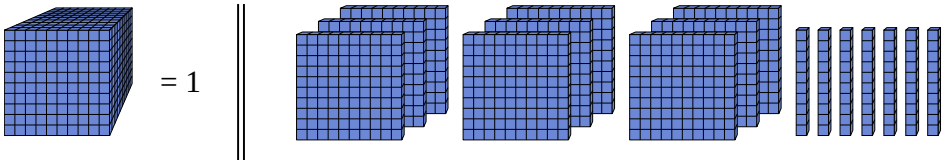

Respuestas

1. _____
2. _____
3. _____
4. _____
5. _____
6. _____
7. _____
8. _____
9. _____
10. _____

1-10	90	80	70	60	50	40	30	20	10	0

Determinación del valor decimal con bloques Nombre: **Clave De Respuestas**

Utilice el bloque de la izquierda para encontrar el valor del conjunto de bloques de la derecha.

1) 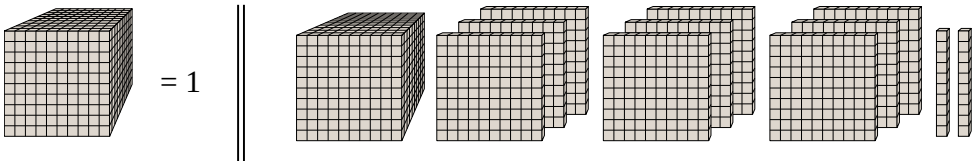

2) 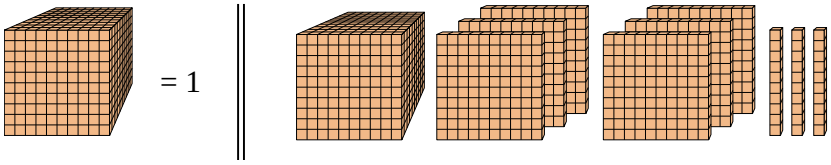

3) 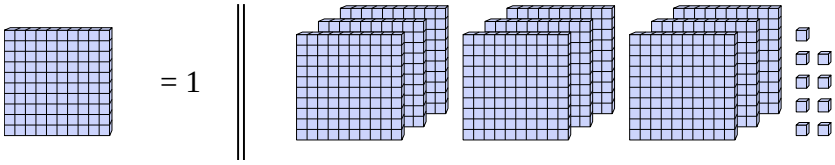

4) 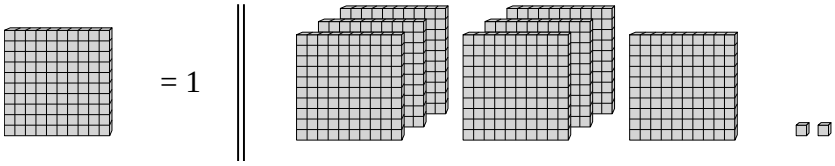

5) 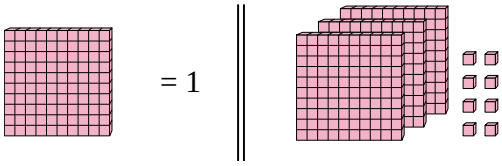

6) 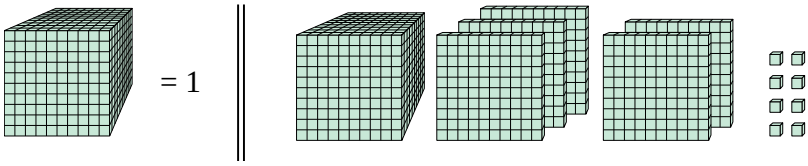

7) 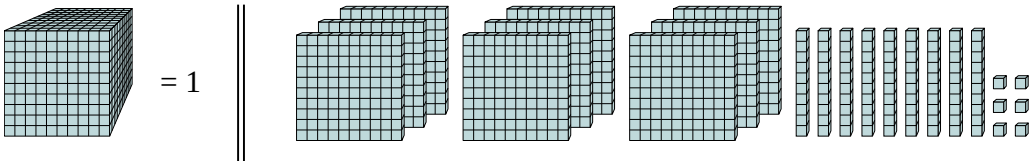

8) 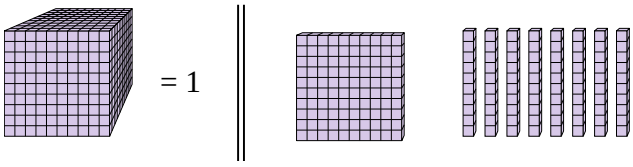

9) 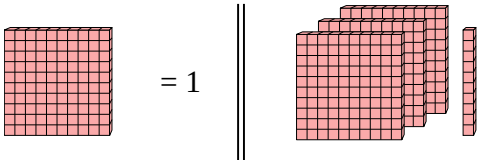

10) 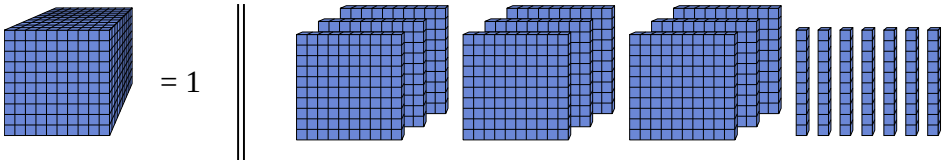

Respuestas

1. **1.92**
2. **1.63**
3. **9.09**
4. **7.02**
5. **3.08**
6. **1.508**
7. **0.996**
8. **0.18**
9. **3.1**
10. **0.97**

1-10	90	80	70	60	50	40	30	20	10	0

Determinación del valor decimal con bloques

Nombre:

Utilice el bloque de la izquierda para encontrar el valor del conjunto de bloques de la derecha.

1) 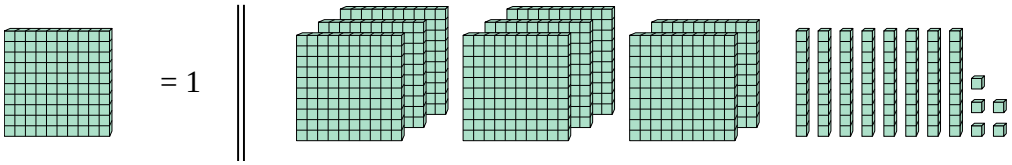

2) 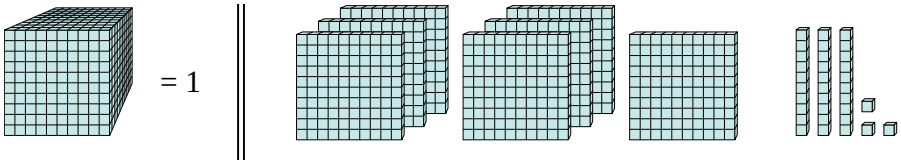

3) 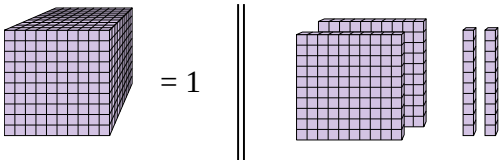

4) 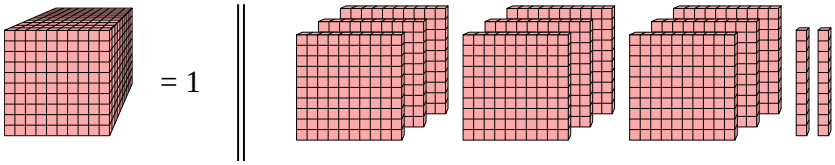

5) 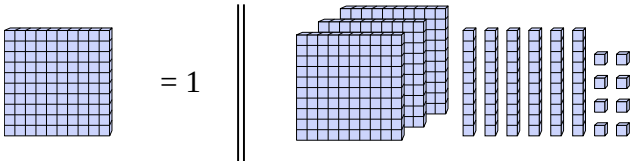

6) 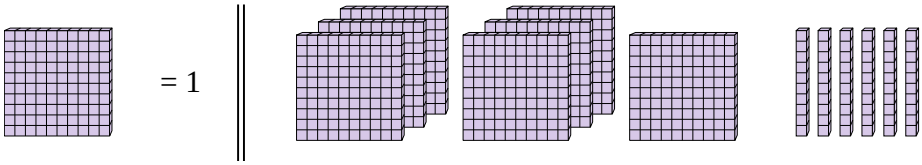

7) 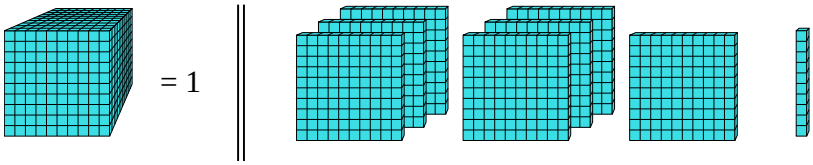

8) 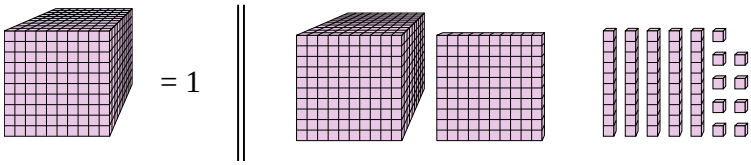

9) 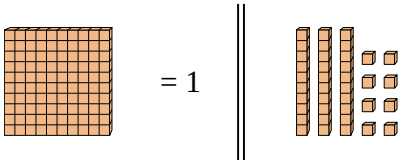

10) 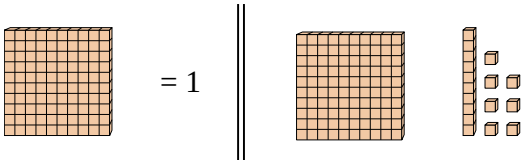

Respuestas

1. _____
2. _____
3. _____
4. _____
5. _____
6. _____
7. _____
8. _____
9. _____
10. _____

1-10	90	80	70	60	50	40	30	20	10	0

Determinación del valor decimal con bloques Nombre: **Clave De Respuestas**

Utilice el bloque de la izquierda para encontrar el valor del conjunto de bloques de la derecha.

1) 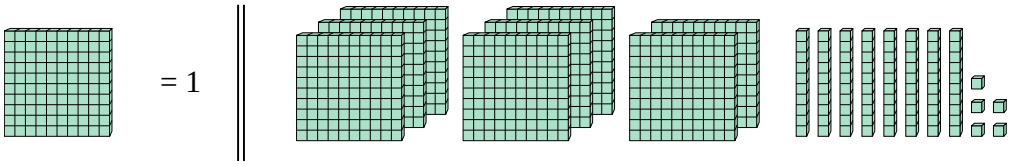

2) 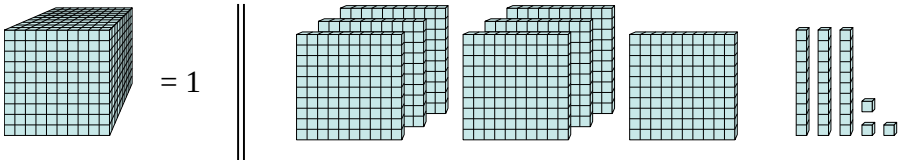

3) 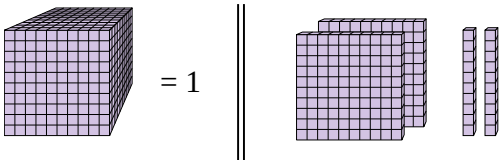

4) 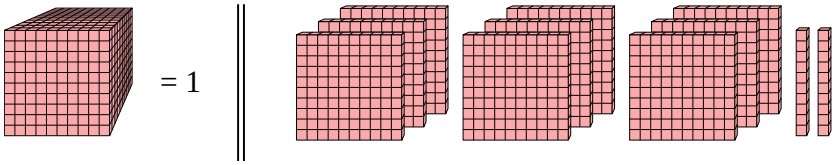

5) 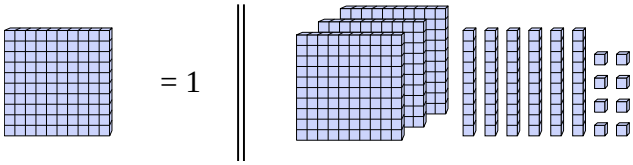

6) 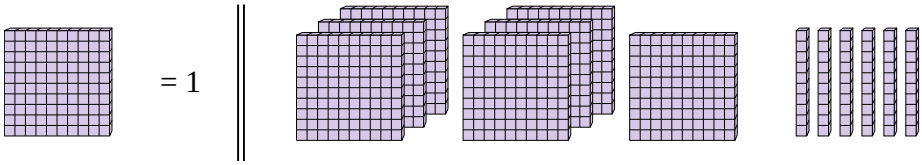

7) 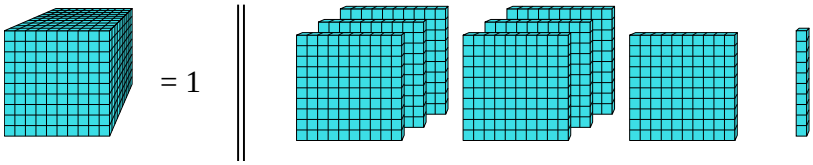

8) 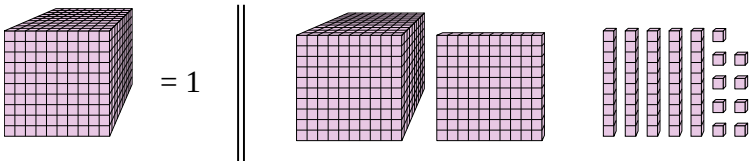

9) 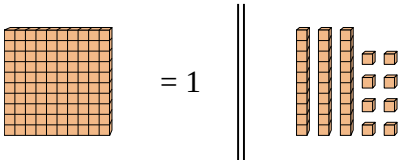

10) 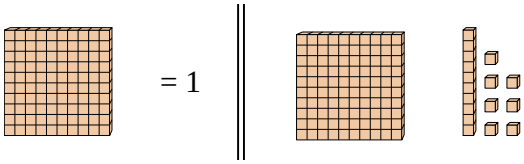

Respuestas

1. **8.85**
2. **0.733**
3. **0.22**
4. **0.92**
5. **3.68**
6. **7.6**
7. **0.71**
8. **1.159**
9. **0.38**
10. **1.17**

1-10	90	80	70	60	50	40	30	20	10	0

Determinación del valor decimal con bloques

Nombre:

Utilice el bloque de la izquierda para encontrar el valor del conjunto de bloques de la derecha.

1) 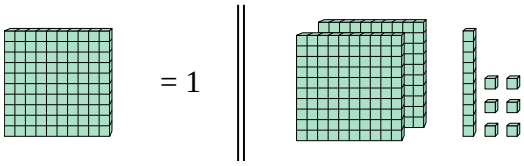

2) 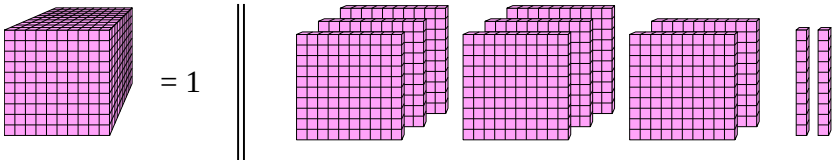

3) 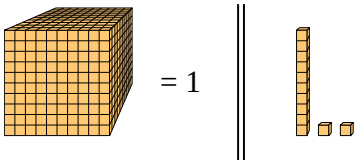

4) 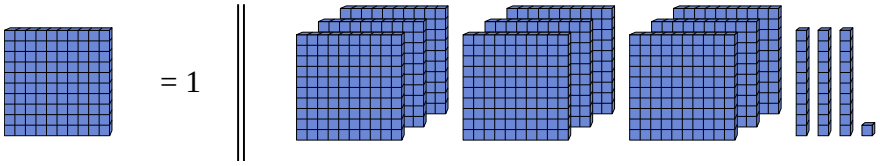

5) 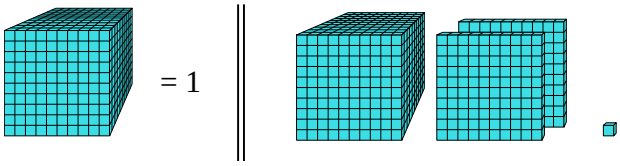

6) 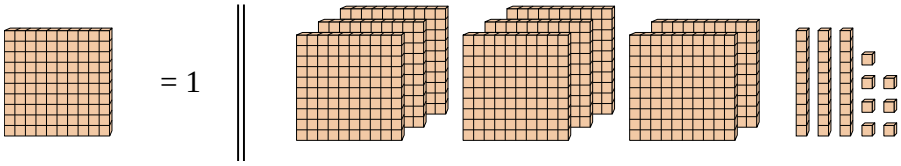

7) 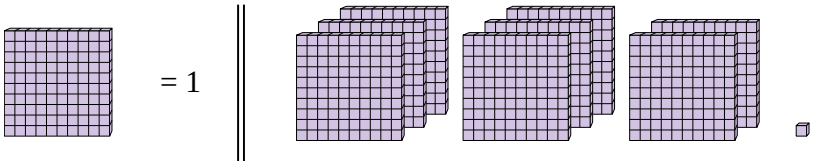

8) 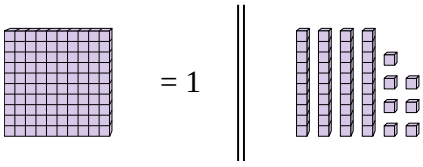

9) 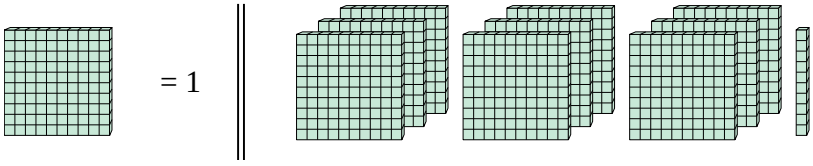

10) 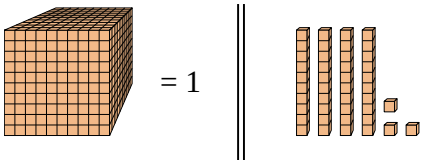

Respuestas

1. _____
2. _____
3. _____
4. _____
5. _____
6. _____
7. _____
8. _____
9. _____
10. _____

1-10	90	80	70	60	50	40	30	20	10	0

Utilice el bloque de la izquierda para encontrar el valor del conjunto de bloques de la derecha.

1) 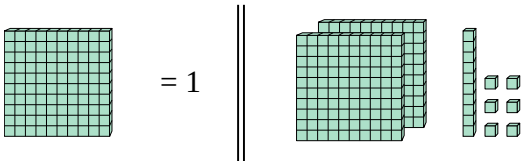

2) 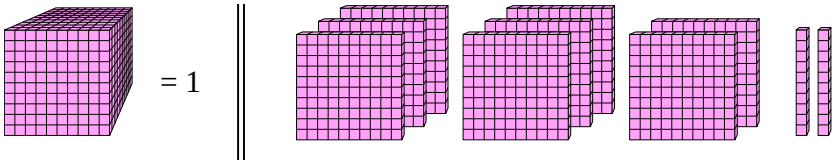

3) 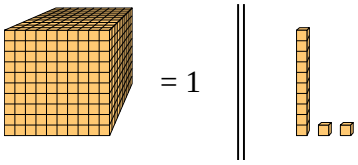

4) 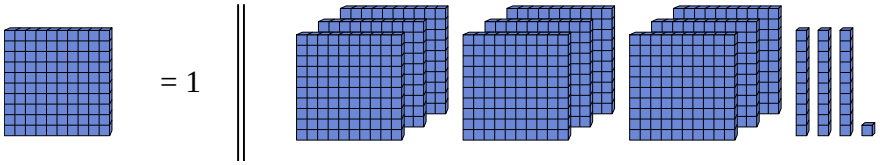

5) 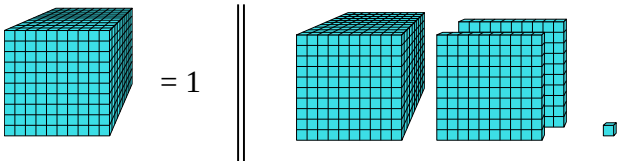

6) 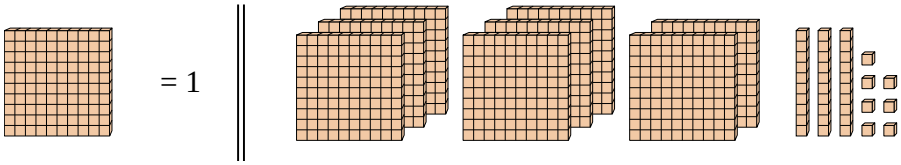

7) 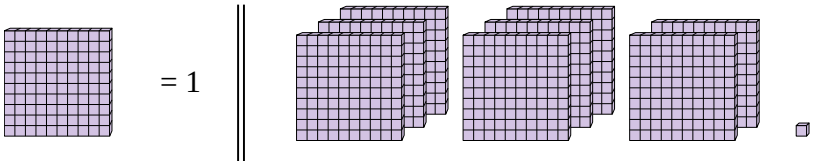

8) 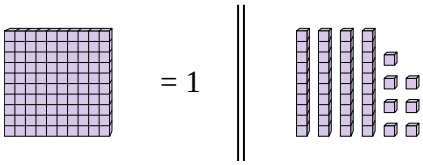

9) 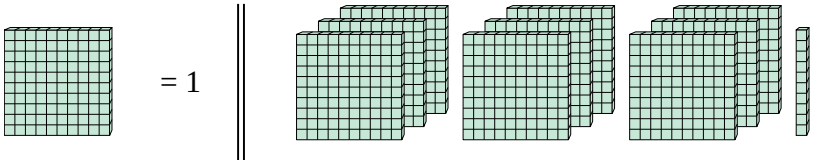

10) 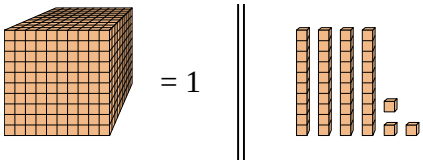

Respuestas

1. **2.16**
2. **0.82**
3. **0.012**
4. **9.31**
5. **1.201**
6. **8.37**
7. **8.01**
8. **0.47**
9. **9.1**
10. **0.043**

1-10	90	80	70	60	50	40	30	20	10	0

Determinación del valor decimal con bloques Nombre:

Utilice el bloque de la izquierda para encontrar el valor del conjunto de bloques de la derecha.

1) 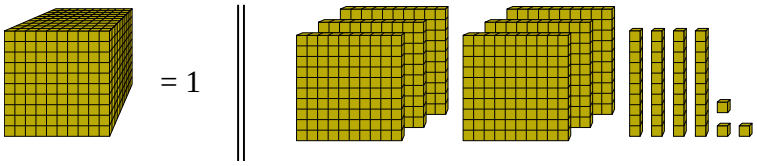

2) 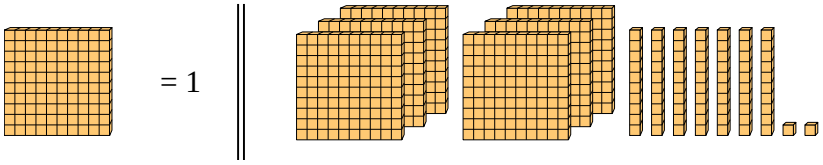

3) 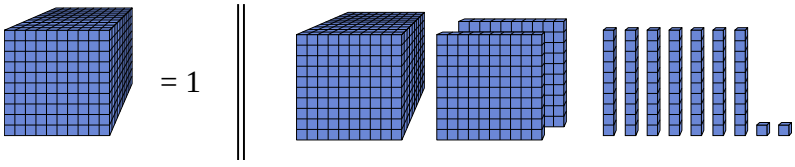

4) 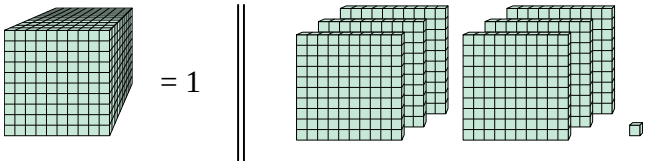

5) 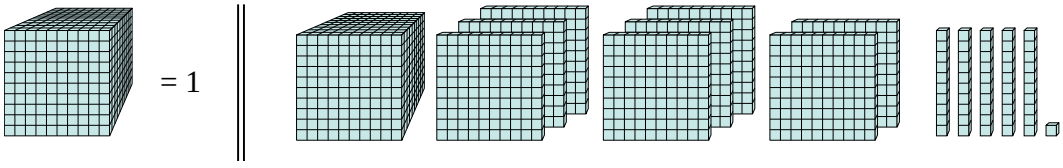

6) 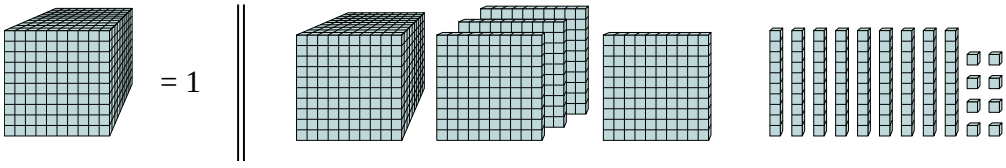

7) 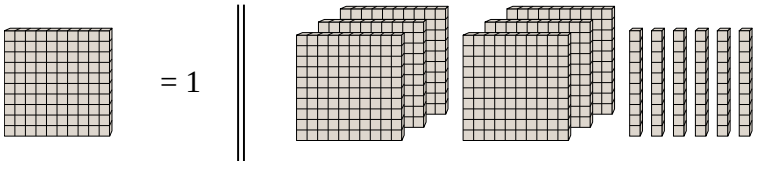

8) 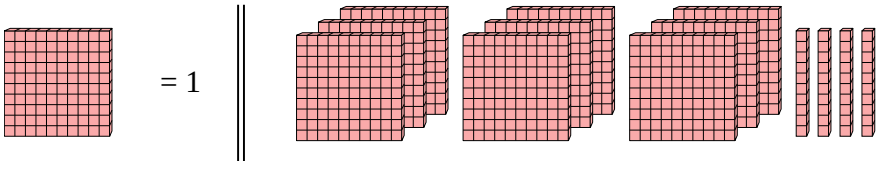

9) 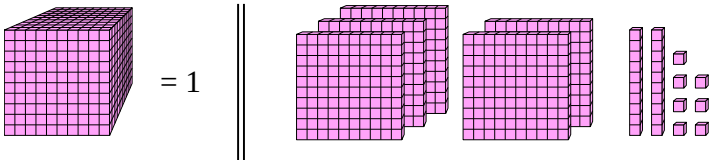

10) 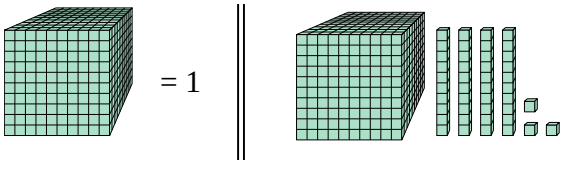

Respuestas

1. _____
2. _____
3. _____
4. _____
5. _____
6. _____
7. _____
8. _____
9. _____
10. _____

1-10	90	80	70	60	50	40	30	20	10	0

Determinación del valor decimal con bloques Nombre: **Clave De Respuestas**

Utilice el bloque de la izquierda para encontrar el valor del conjunto de bloques de la derecha.

1) 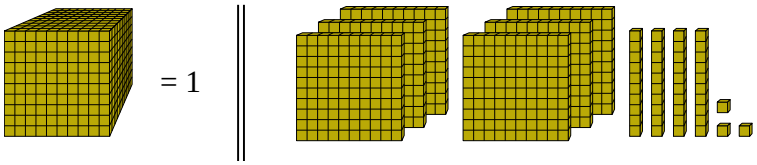

2) 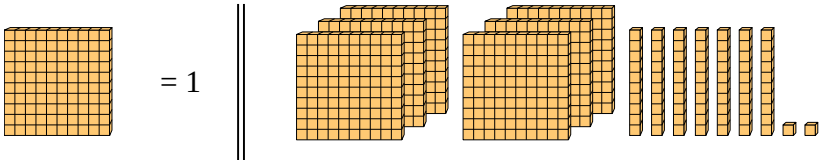

3) 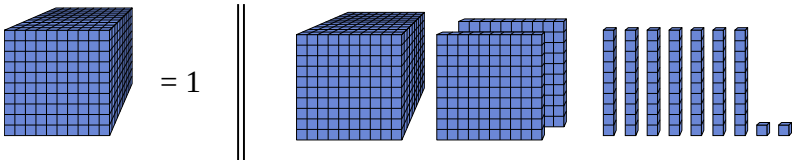

4) 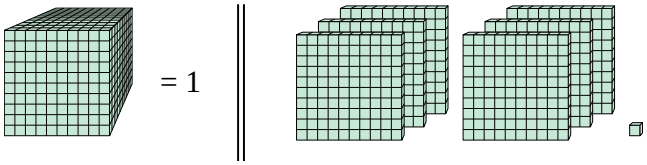

5) 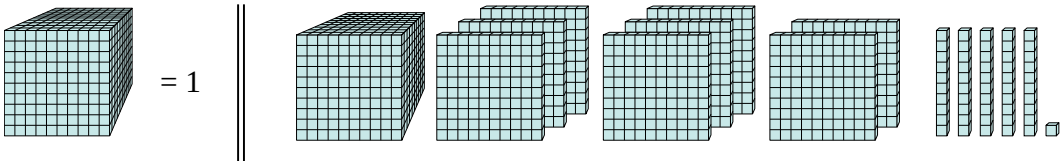

6) 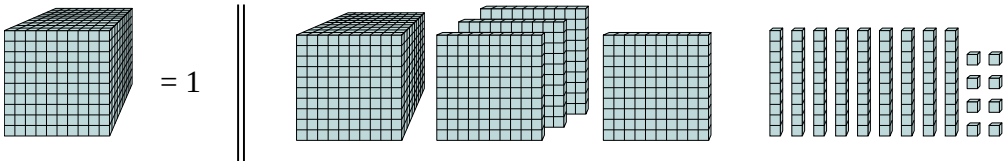

7) 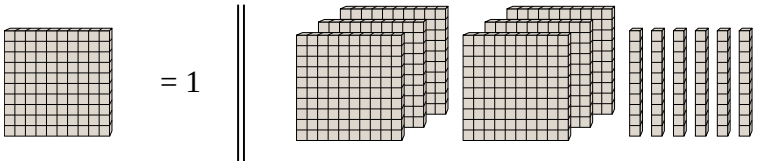

8) 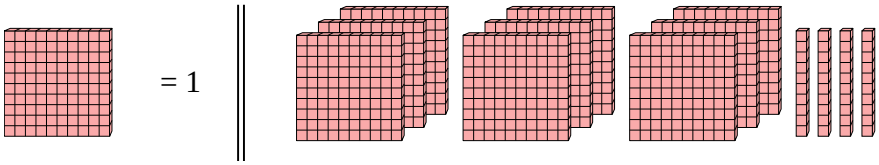

9) 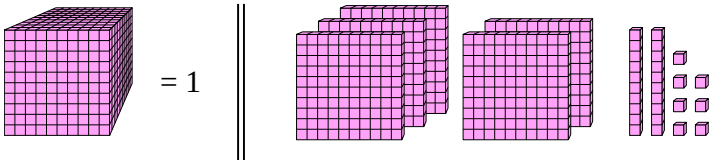

10) 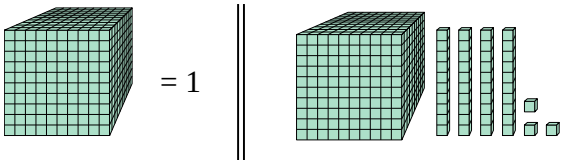

Respuestas

1. **0.643**
2. **6.72**
3. **1.272**
4. **0.601**
5. **1.851**
6. **1.498**
7. **6.6**
8. **9.4**
9. **0.527**
10. **1.043**

1-10	90	80	70	60	50	40	30	20	10	0