Determinación del valor decimal con bloques

Nombre:

Utilice el bloque de la izquierda para encontrar el valor del conjunto de bloques de la derecha.

1) 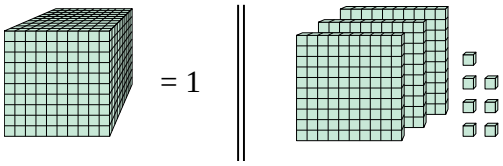

2) 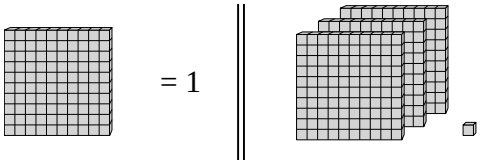

3) 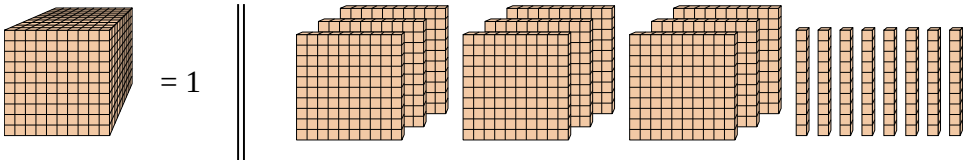

4) 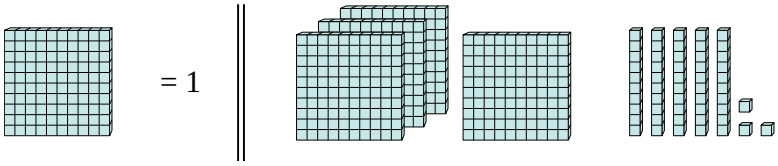

5) 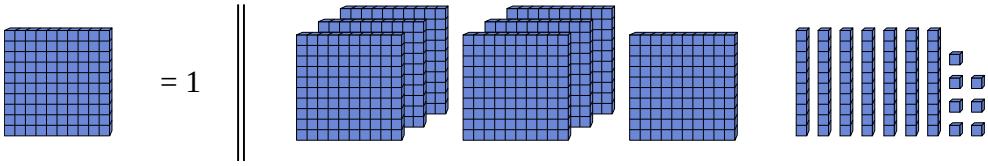

6) 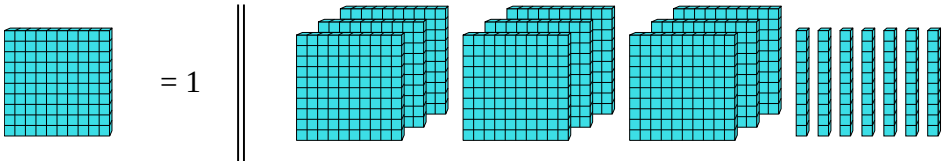

7) 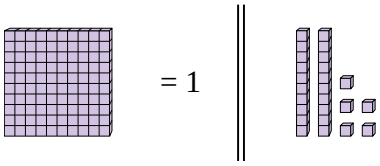

8) 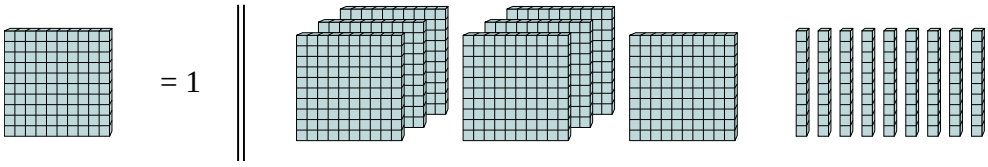

9) 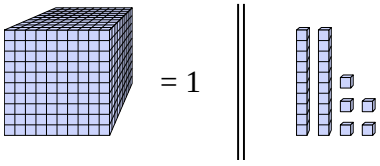

10) 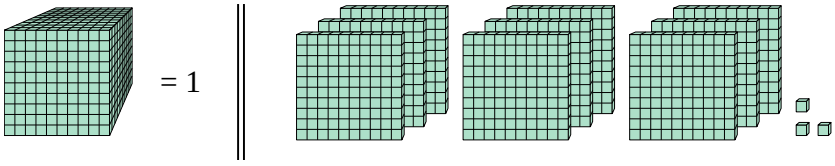

Respuestas

1. _____
2. _____
3. _____
4. _____
5. _____
6. _____
7. _____
8. _____
9. _____
10. _____

1-10	90	80	70	60	50	40	30	20	10	0

Determinación del valor decimal con bloques

Nombre: **Clave De Respuestas**

Utilice el bloque de la izquierda para encontrar el valor del conjunto de bloques de la derecha.

1) 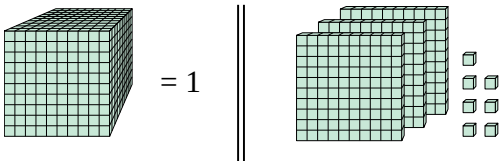

2) 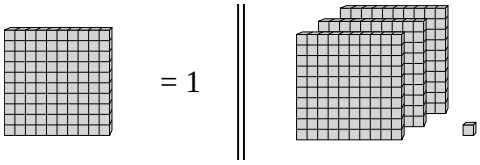

3) 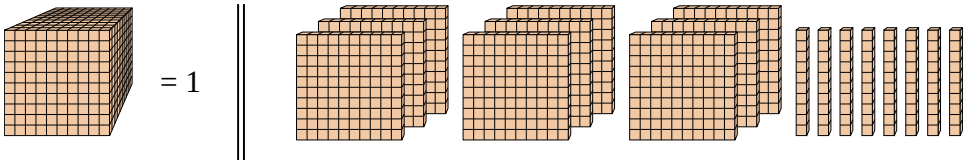

4) 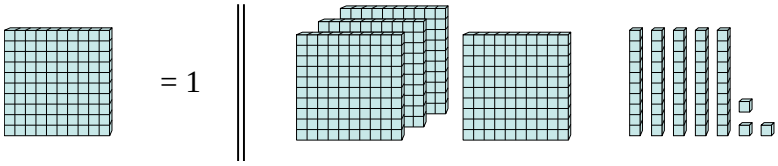

5) 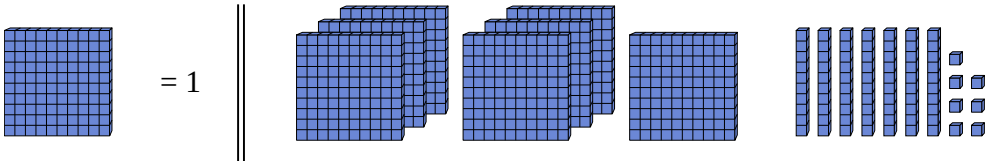

6) 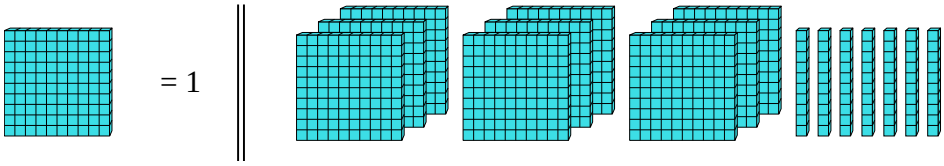

7) 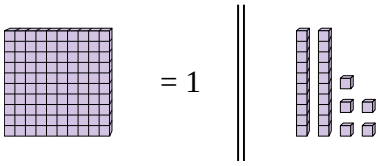

8) 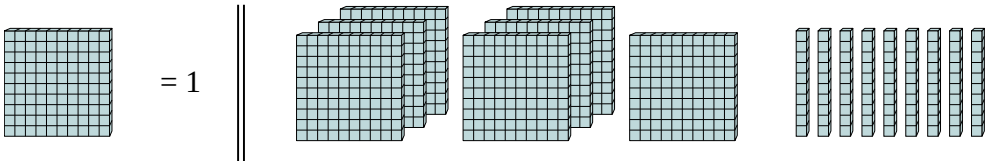

9) 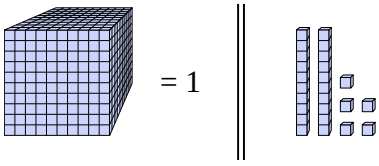

10) 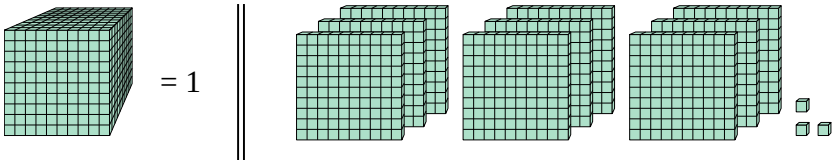

Respuestas

1. **0.307**
2. **3.01**
3. **0.98**
4. **4.53**
5. **7.77**
6. **9.7**
7. **0.25**
8. **7.9**
9. **0.025**
10. **0.903**