Ordenando Decimales (Visualmente)

Nombre:

Pon las cajas en orden de la menor a la mayor basado en la cantidad sombreada.

Ej) A B C D

menor 0.05 - B
0.57 - D
0.62 - C
mayor 0.9 - A

1) A B C D

menor _____
_____
_____
mayor _____

2) A B C D

menor _____
_____
_____
mayor _____

3) A B C D

menor _____
_____
_____
mayor _____

4) A B C D

menor _____
_____
_____
mayor _____

5) A B C D

menor _____
_____
_____
mayor _____

6) A B C D

menor _____
_____
_____
mayor _____

7) A B C D

menor _____
_____
_____
mayor _____

8) A B C D

menor _____
_____
_____
mayor _____

Respuestas

Ej. **B,D,C,A**

1. _____
2. _____
3. _____
4. _____
5. _____
6. _____
7. _____
8. _____

1-8	88	75	63	50	38	25	13	0

Ordenando Decimales (Visualmente) Nombre: **Clave De Respuestas**

Pon las cajas en orden de la menor a la mayor basado en la cantidad sombreada.

Ej)

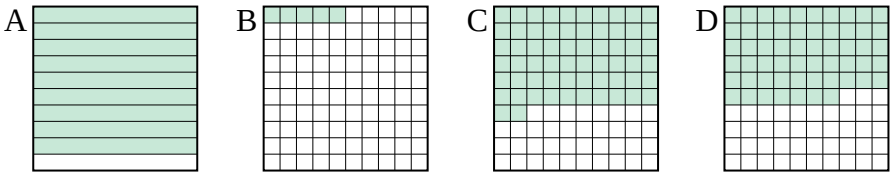

menor 0.05 - B
0.57 - D
0.62 - C
mayor 0.9 - A

1)

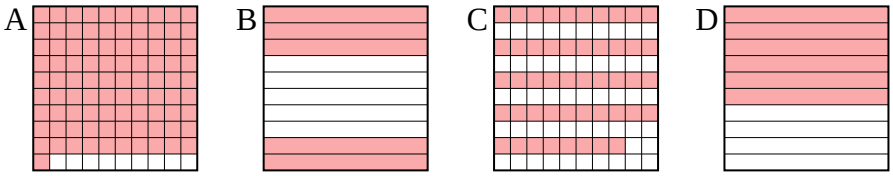

menor 0.48 - C
0.5 - B
0.6 - D
mayor 0.91 - A

2)

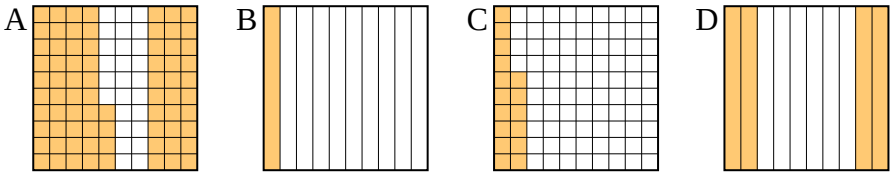

menor 0.1 - B
0.16 - C
0.4 - D
mayor 0.74 - A

3)

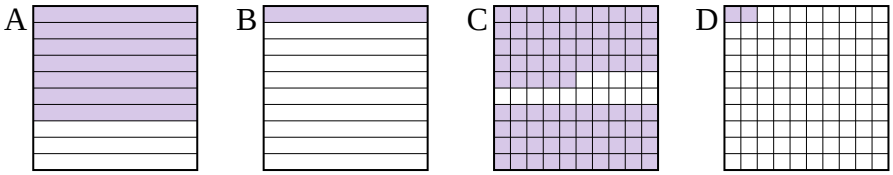

menor 0.02 - D
0.1 - B
0.7 - A
mayor 0.85 - C

4)

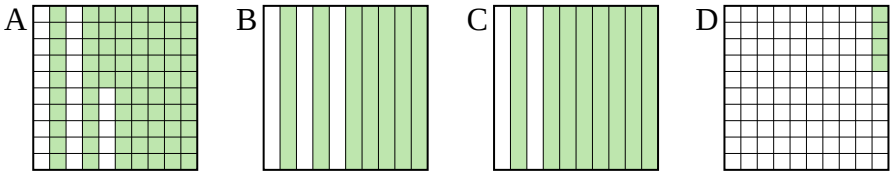

menor 0.04 - D
0.7 - B
0.75 - A
mayor 0.8 - C

5)

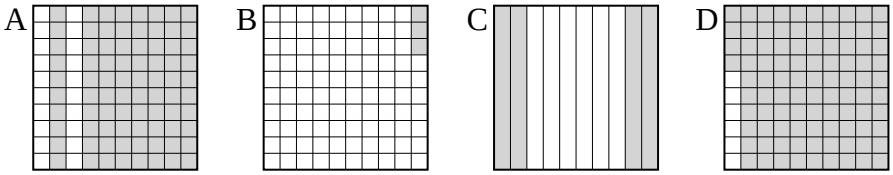

menor 0.03 - B
0.4 - C
0.8 - A
mayor 0.94 - D

6)

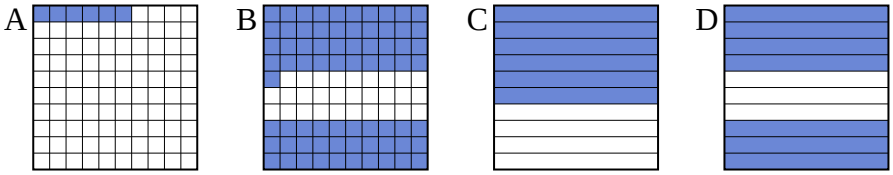

menor 0.06 - A
0.6 - C
0.7 - D
mayor 0.71 - B

7)

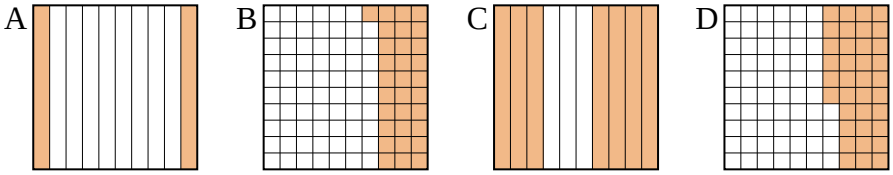

menor 0.2 - A
0.31 - B
0.36 - D
mayor 0.7 - C

8)

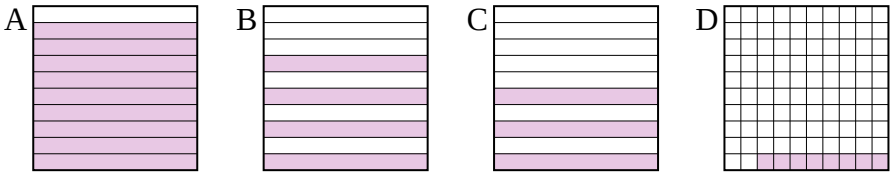

menor 0.08 - D
0.3 - C
0.4 - B
mayor 0.9 - A

Respuestas

Ej. **B,D,C,A**

1. **C,B,D,A**
2. **B,C,D,A**
3. **D,B,A,C**
4. **D,B,A,C**
5. **B,C,A,D**
6. **A,C,D,B**
7. **A,B,D,C**
8. **D,C,B,A**

1-8	88	75	63	50	38	25	13	0