Usa la recta numérica para resolver el problema de división.

1) 20÷5=

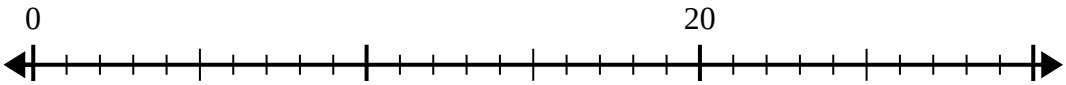

2) 28÷4=

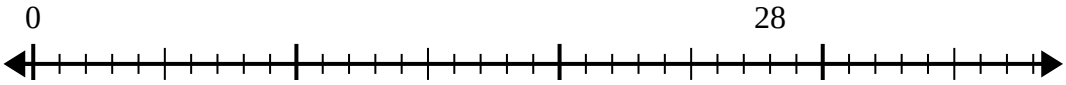

3) 30÷6=

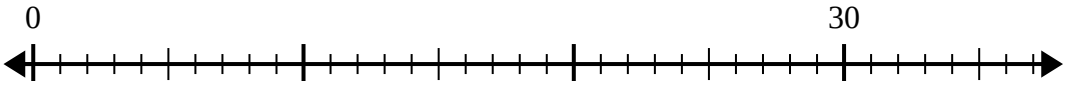

4) 42÷6=

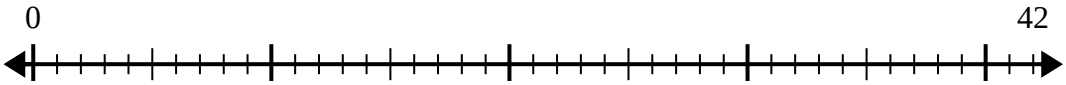

5) 48÷6=

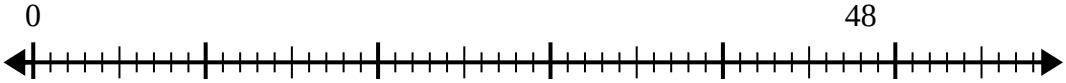

6) 56÷8=

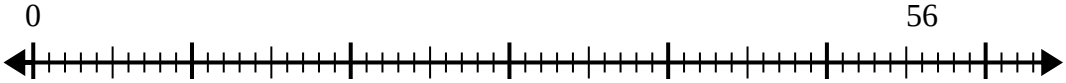

7) 24÷6=

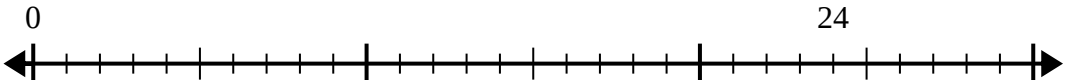

8) 40÷8=

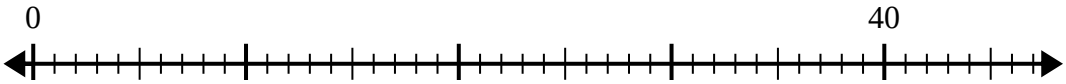

9) 42÷7=

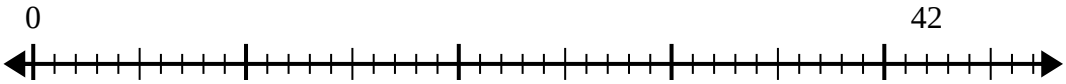

10) 32÷4=

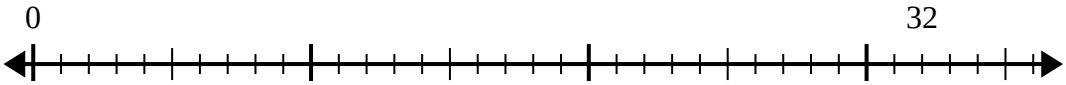

Respuestas

1. _____
2. _____
3. _____
4. _____
5. _____
6. _____
7. _____
8. _____
9. _____
10. _____

1-10	90	80	70	60	50	40	30	20	10	0

Usa la recta numérica para resolver el problema de división.

1) 20÷5=

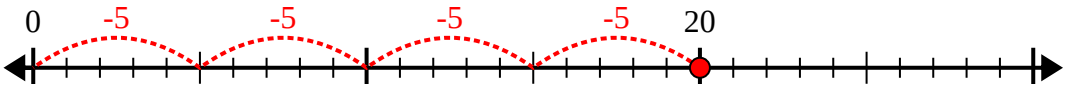

2) 28÷4=

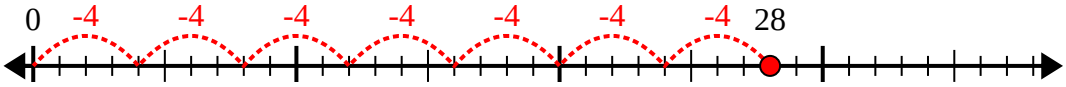

3) 30÷6=

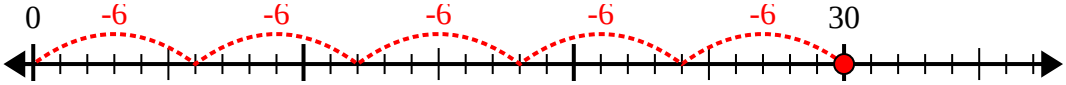

4) 42÷6=

5) 48÷6=

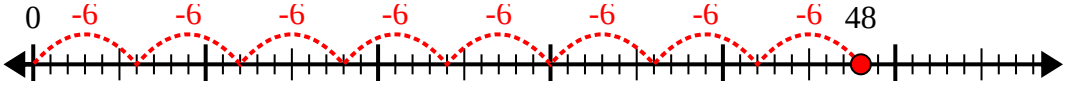

6) 56÷8=

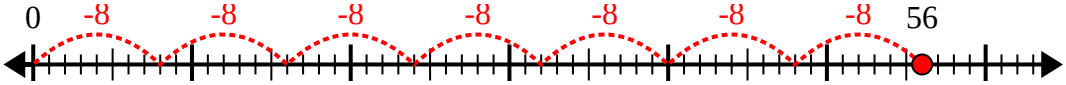

7) 24÷6=

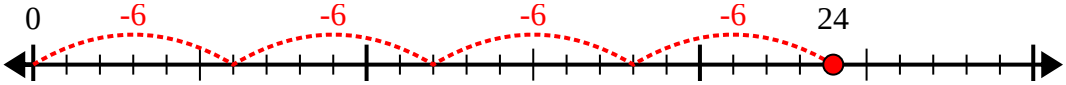

8) 40÷8=

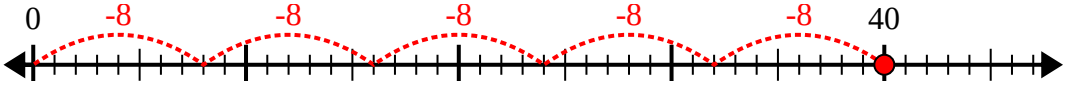

9) 42÷7=

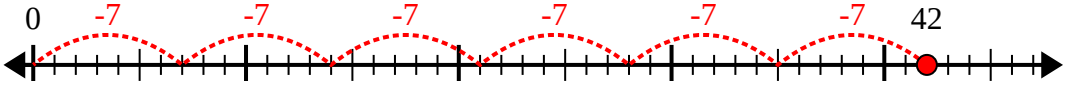

10) 32÷4=

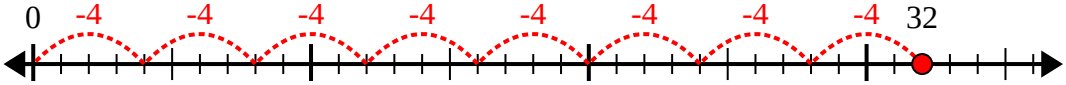

Respuestas

1. **4**
2. **7**
3. **5**
4. **7**
5. **8**
6. **7**
7. **4**
8. **5**
9. **6**
10. **8**

1-10	90	80	70	60	50	40	30	20	10	0