Utilice las rectas numéricas para resolver cada problema.

1) 32 - 5 =

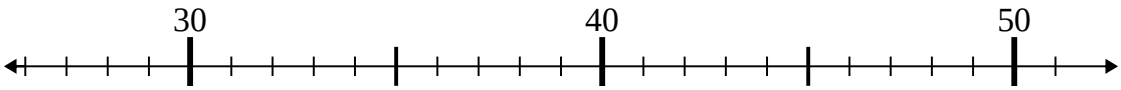

2) 16 + 7 =

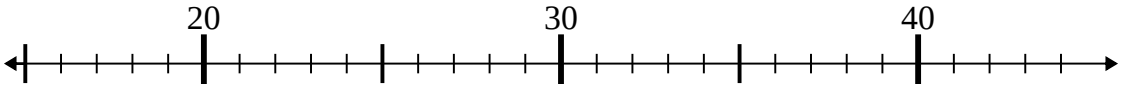

3) 25 + 12 =

4) 75 - 14 =

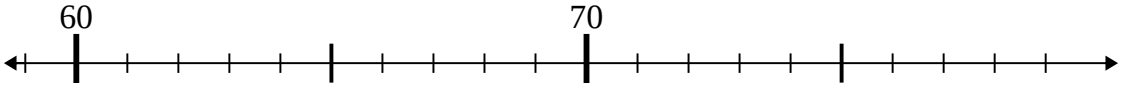

5) 28 + 26 =

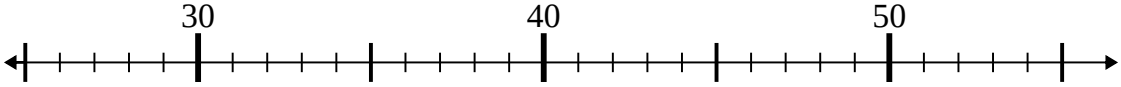

6) 65 - 10 =

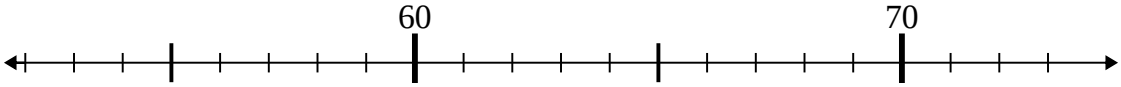

7) 81 - 2 =

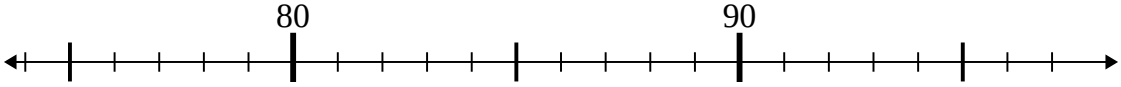

8) 95 - 8 =

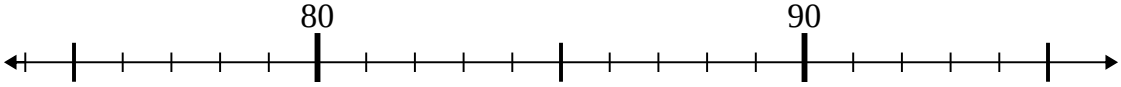

9) 48 - 11 =

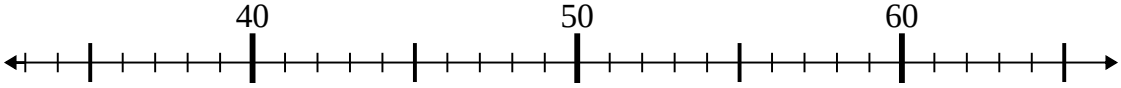

10) 32 + 18 =

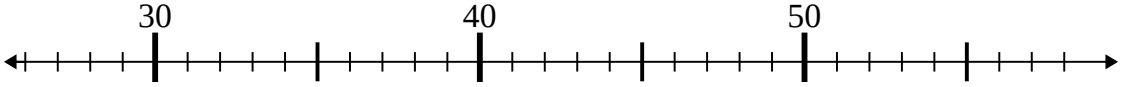

Respuestas

1. _____
2. _____
3. _____
4. _____
5. _____
6. _____
7. _____
8. _____
9. _____
10. _____

1-10	90	80	70	60	50	40	30	20	10	0

Utilice las rectas numéricas para resolver cada problema.

1) 32 - 5 =

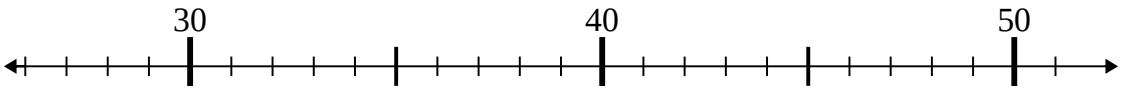

2) 16 + 7 =

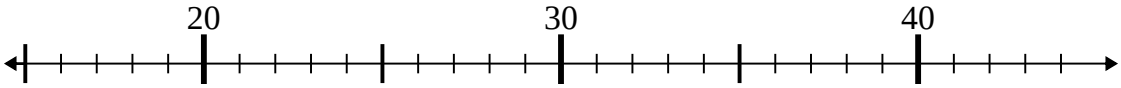

3) 25 + 12 =

4) 75 - 14 =

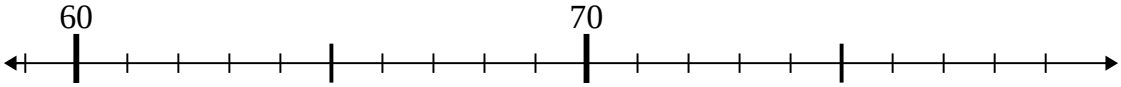

5) 28 + 26 =

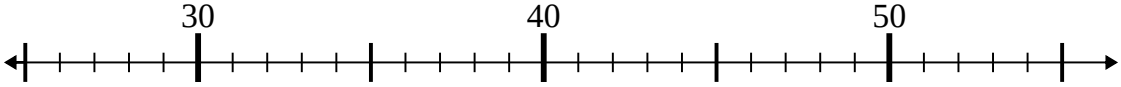

6) 65 - 10 =

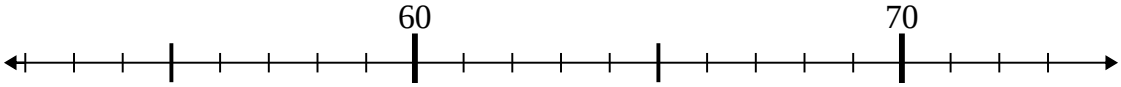

7) 81 - 2 =

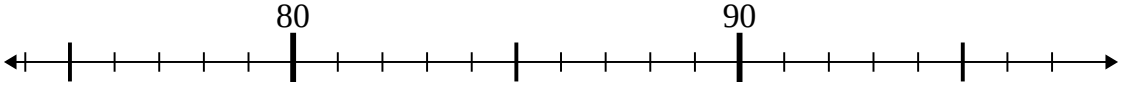

8) 95 - 8 =

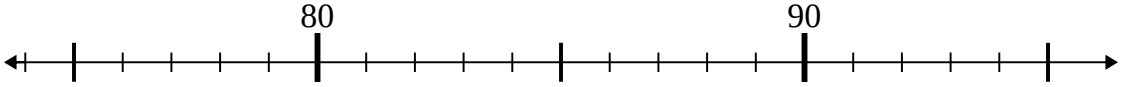

9) 48 - 11 =

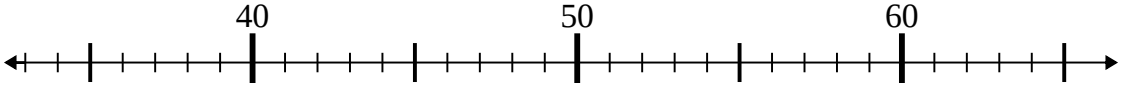

10) 32 + 18 =

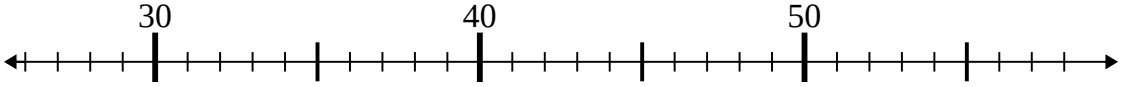

Respuestas

1. **27**
2. **23**
3. **37**
4. **61**
5. **54**
6. **55**
7. **79**
8. **87**
9. **37**
10. **50**

1-10	90	80	70	60	50	40	30	20	10	0