Determinando fracciones Relativamente a la Mitad Nombre:

Determina si el área sombreada es 'más', 'menos' o 'igual' que la mitad.

1) 

2)

3) 

4) 

5) 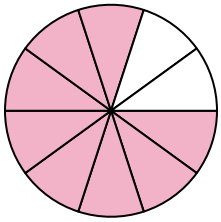

6) 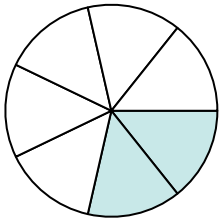

7) 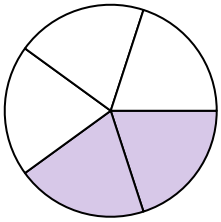

8) 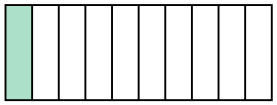

9) 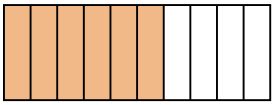

10)

11) 

12)

13) 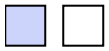

14)

15)

16)

17) 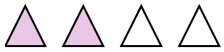

18)

19)

20) 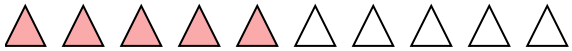

Respuestas

1. _____
2. _____
3. _____
4. _____
5. _____
6. _____
7. _____
8. _____
9. _____
10. _____
11. _____
12. _____
13. _____
14. _____
15. _____
16. _____
17. _____
18. _____
19. _____
20. _____

1-10	95	90	85	80	75	70	65	60	55	50
11-20	45	40	35	30	25	20	15	10	5	0

Determina si el área sombreada es 'más', 'menos' o 'igual' que la mitad.

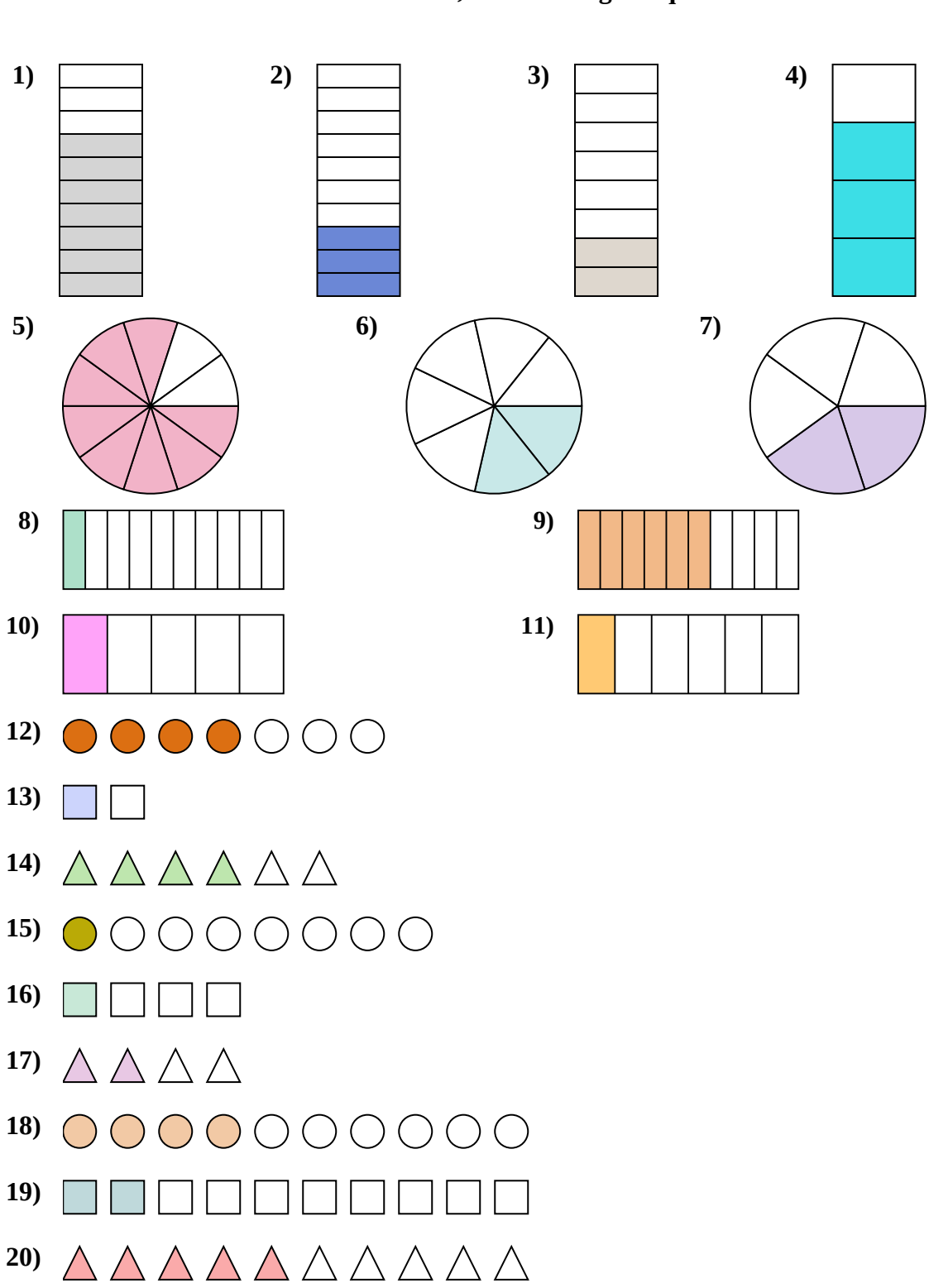

Respuestas

1. mayor
2. menor
3. menor
4. mayor
5. mayor
6. menor
7. menor
8. menor
9. mayor
10. menor
11. menor
12. mayor
13. igual
14. mayor
15. menor
16. menor
17. igual
18. menor
19. menor
20. igual

1-10	95	90	85	80	75	70	65	60	55	50
11-20	45	40	35	30	25	20	15	10	5	0