Determinando fracciones Relativamente a la Mitad

Nombre:

Determina si el área sombreada es 'más', 'menos' o 'igual' que la mitad.

1)



2)

3)

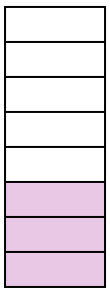

4)

5)

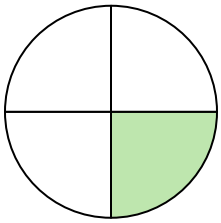

6)

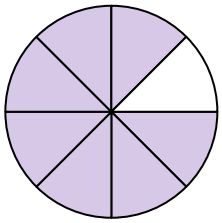

7)

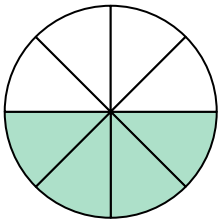

8)

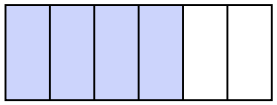

9)

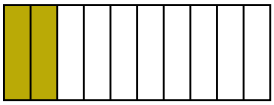

10)

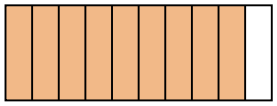

11)

12)



13)



14)

15)

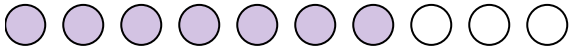

16)

17)

18)

19)

20)

Respuestas

1. _____
2. _____
3. _____
4. _____
5. _____
6. _____
7. _____
8. _____
9. _____
10. _____
11. _____
12. _____
13. _____
14. _____
15. _____
16. _____
17. _____
18. _____
19. _____
20. _____

1-10	95	90	85	80	75	70	65	60	55	50
11-20	45	40	35	30	25	20	15	10	5	0

Determinando fracciones Relativamente a la Mitad

Nombre: **Clave De Respuestas**

Determina si el área sombreada es 'más', 'menos' o 'igual' que la mitad.

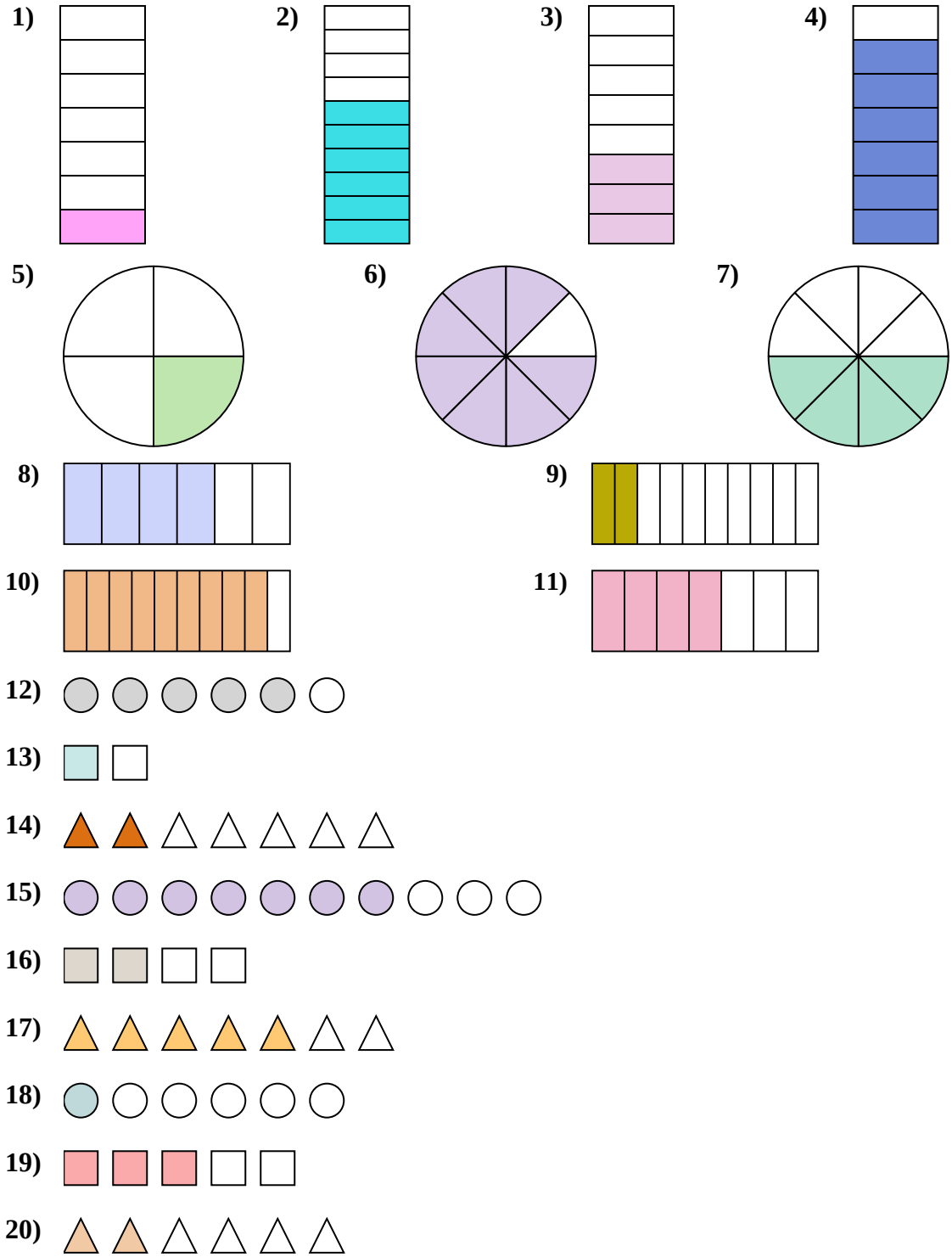

Respuestas

1. menor
2. mayor
3. menor
4. mayor
5. menor
6. mayor
7. igual
8. mayor
9. menor
10. mayor
11. mayor
12. mayor
13. igual
14. menor
15. mayor
16. igual
17. mayor
18. menor
19. mayor
20. menor

1-10	95	90	85	80	75	70	65	60	55	50
11-20	45	40	35	30	25	20	15	10	5	0