Encontrando la distancia en el plano cartesiano Nombre:

Encuentra la distancia entre puntos. Redondea tu respuesta al decimal más cercano.

Ej)

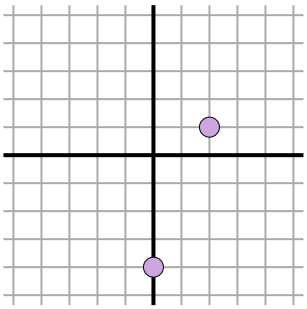

1)

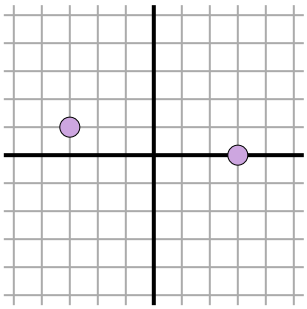

2)

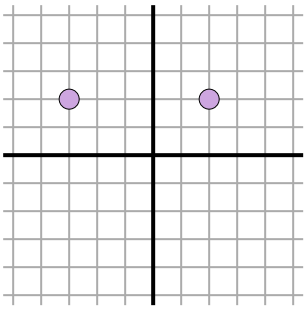

3)

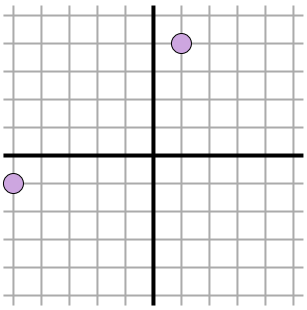

4)

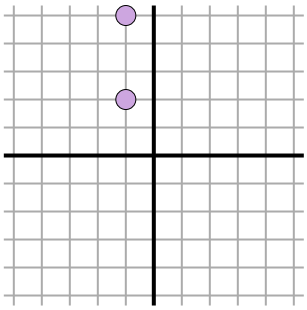

5)

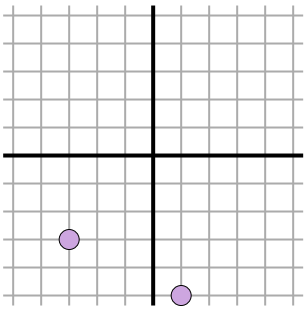

6)

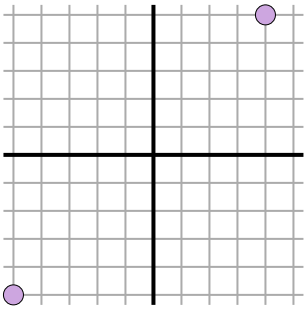

7)

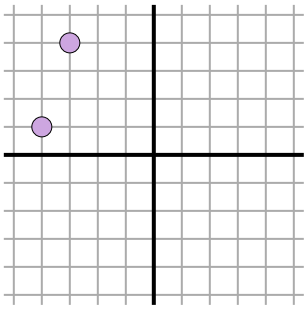

8)

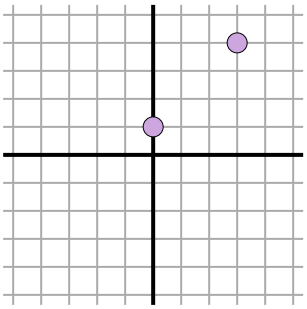

9)

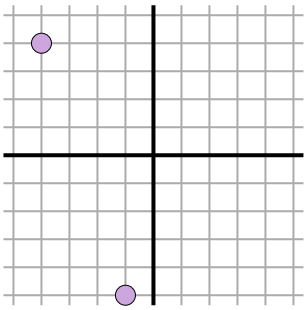

10)

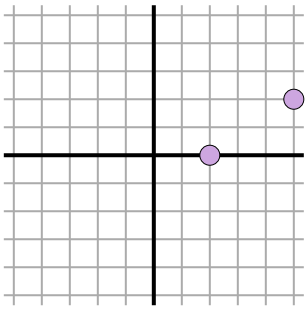

11)

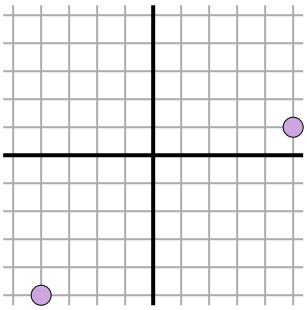

Respuestas

Ej. 5.4

1. _____
2. _____
3. _____
4. _____
5. _____
6. _____
7. _____
8. _____
9. _____
10. _____
11. _____

1-10	91	82	73	64	55	45	36	27	18	9
11	0									

Encontrando la distancia en el plano cartesiano Nombre: **Clave De Respuestas**

Encuentra la distancia entre puntos. Redondea tu respuesta al decimal más cercano.

Ej)

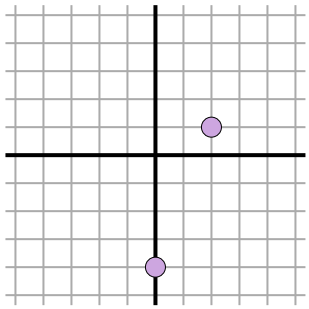

$\sqrt{(2-0)^2 + (1--4)^2}$

$\sqrt{(4) + (25)}$

1)

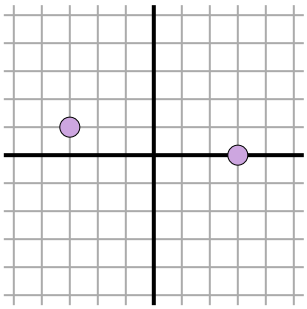

$\sqrt{(3--3)^2 + (0-1)^2}$

$\sqrt{(36) + (1)}$

2)

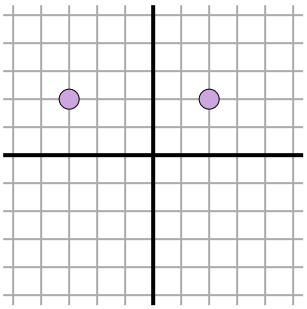

$\sqrt{(2--3)^2 + (2-2)^2}$

$\sqrt{(25) + (0)}$

3)

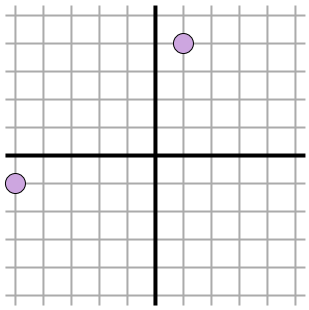

$\sqrt{(1--5)^2 + (4--1)^2}$

$\sqrt{(36) + (25)}$

4)

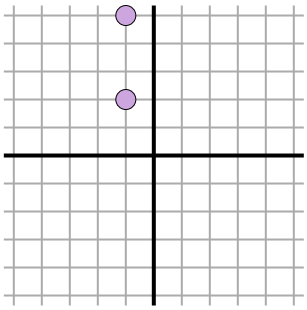

$\sqrt{(-1--1)^2 + (2-5)^2}$

$\sqrt{(0) + (9)}$

5)

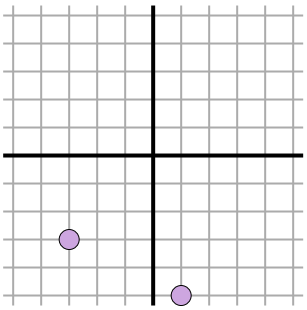

$\sqrt{(1--3)^2 + (-5--3)^2}$

$\sqrt{(16) + (4)}$

6)

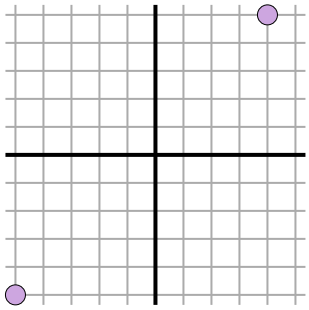

$\sqrt{(4--5)^2 + (5--5)^2}$

$\sqrt{(81) + (100)}$

7)

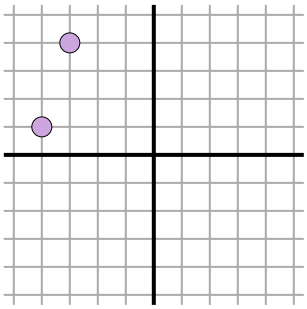

$\sqrt{(-4--3)^2 + (1-4)^2}$

$\sqrt{(1) + (9)}$

8)

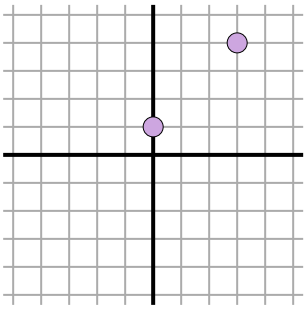

$\sqrt{(0-3)^2 + (1-4)^2}$

$\sqrt{(9) + (9)}$

9)

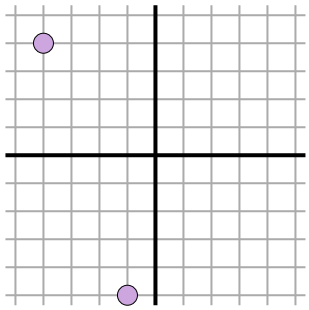

$\sqrt{(-1--4)^2 + (-5-4)^2}$

$\sqrt{(9) + (81)}$

10)

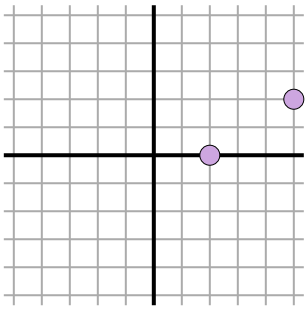

$\sqrt{(2-5)^2 + (0-2)^2}$

$\sqrt{(9) + (4)}$

11)

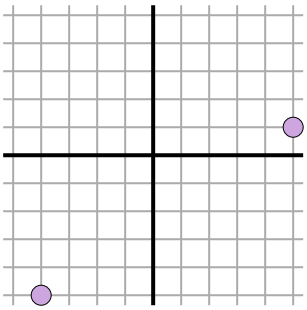

$\sqrt{(-4-5)^2 + (-5-1)^2}$

$\sqrt{(81) + (36)}$

Respuestas

Ej.	5.4
1.	6.1
2.	5
3.	7.8
4.	3
5.	4.5
6.	13.5
7.	3.2
8.	4.2
9.	9.5
10.	3.6
11.	10.8

1-10	91	82	73	64	55	45	36	27	18	9
11	0									