Encontrando la distancia en un plano cartesiano Nombre:

Encuentra la distancia entre puntos.

Ej)

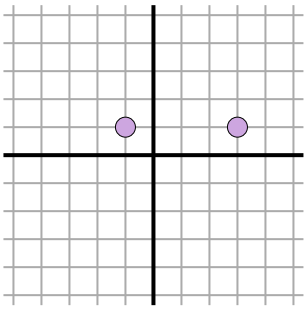

1)

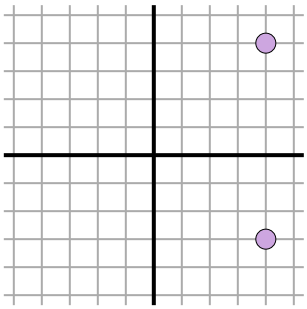

2)

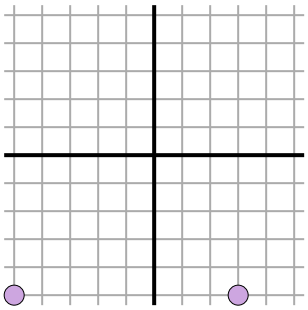

3)

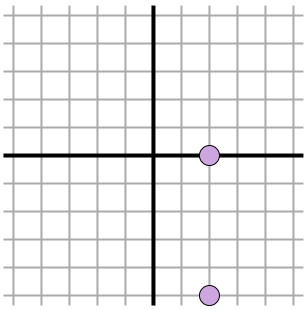

4)

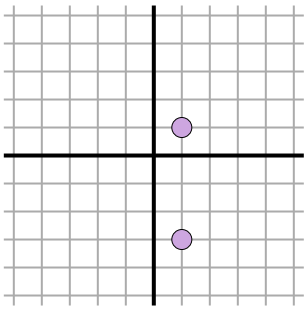

5)

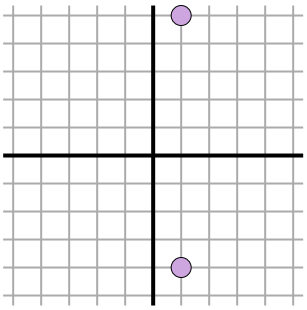

6)

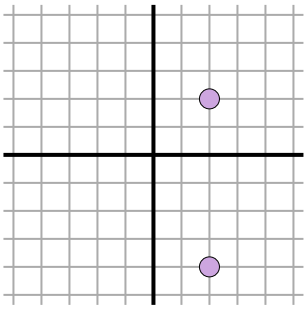

7)

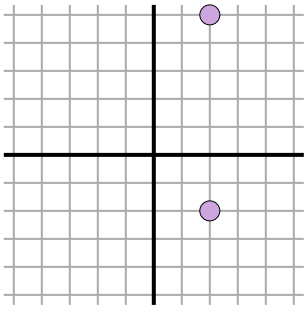

8)

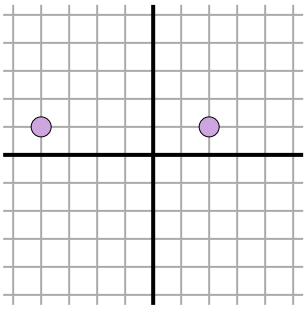

9)

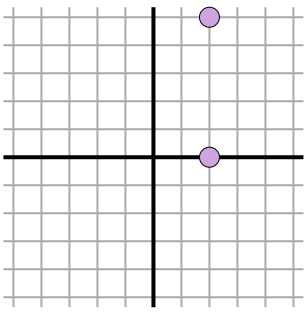

10)

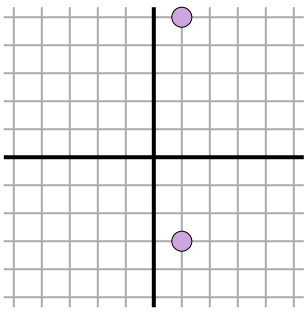

11)

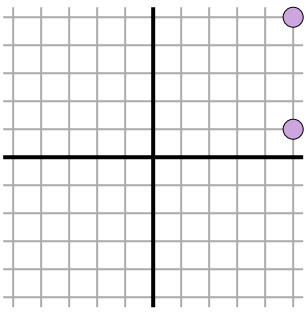

Respuestas

Ej. 4

1. _____
2. _____
3. _____
4. _____
5. _____
6. _____
7. _____
8. _____
9. _____
10. _____
11. _____

1-10	91	82	73	64	55	45	36	27	18	9
11	0									

Encontrando la distancia en un plano cartesiano

Nombre: **Clave De Respuestas**

Encuentra la distancia entre puntos.

Ej)

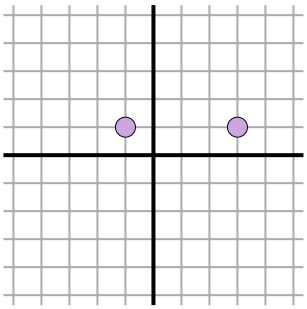

$\sqrt{(-1-3)^2 + (1-1)^2}$

$\sqrt{(16) + (0)}$

1)

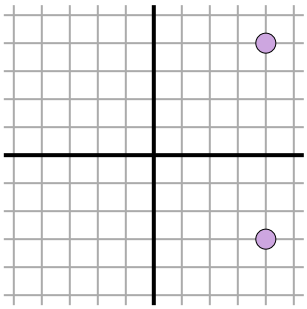

$\sqrt{(4-4)^2 + (4--3)^2}$

$\sqrt{(0) + (49)}$

2)

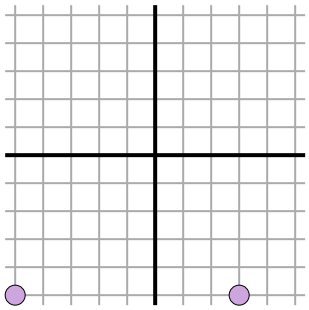

$\sqrt{(3--5)^2 + (-5--5)^2}$

$\sqrt{(64) + (0)}$

3)

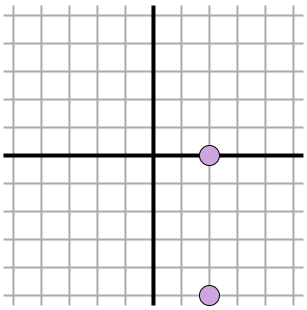

$\sqrt{(2-2)^2 + (0--5)^2}$

$\sqrt{(0) + (25)}$

4)

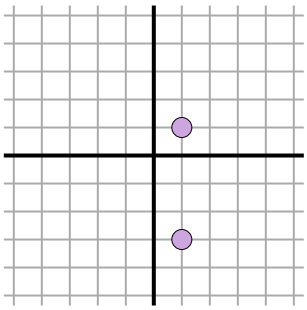

$\sqrt{(1-1)^2 + (-3-1)^2}$

$\sqrt{(0) + (16)}$

5)

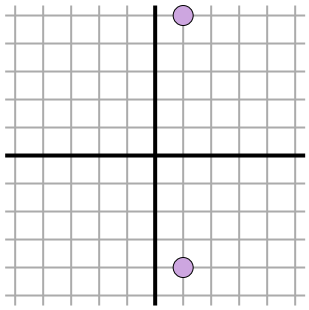

$\sqrt{(1-1)^2 + (-4-5)^2}$

$\sqrt{(0) + (81)}$

6)

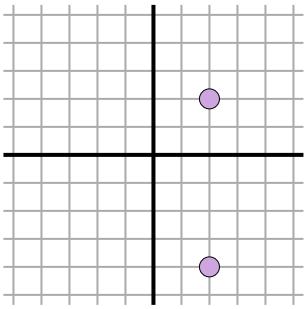

$\sqrt{(2-2)^2 + (2--4)^2}$

$\sqrt{(0) + (36)}$

7)

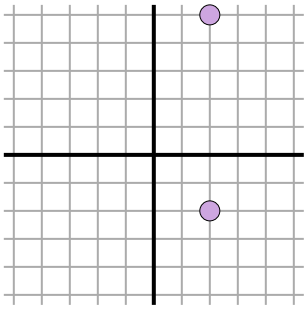

$\sqrt{(2-2)^2 + (5--2)^2}$

$\sqrt{(0) + (49)}$

8)

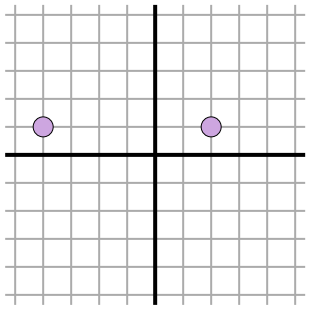

$\sqrt{(-4-2)^2 + (1-1)^2}$

$\sqrt{(36) + (0)}$

9)

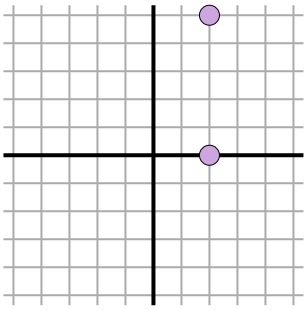

$\sqrt{(2-2)^2 + (5-0)^2}$

$\sqrt{(0) + (25)}$

10)

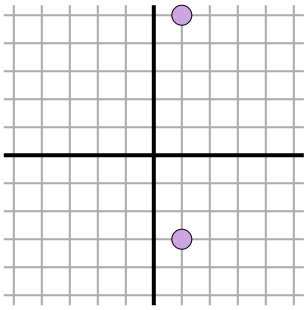

$\sqrt{(1-1)^2 + (-3-5)^2}$

$\sqrt{(0) + (64)}$

11)

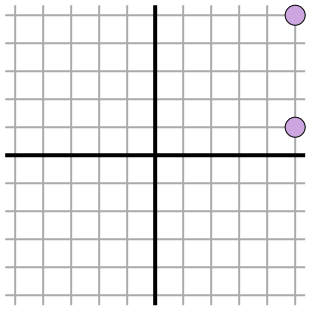

$\sqrt{(5-5)^2 + (1-5)^2}$

$\sqrt{(0) + (16)}$

Respuestas

Ej.	4
1.	7
2.	8
3.	5
4.	4
5.	9
6.	6
7.	7
8.	6
9.	5
10.	8
11.	4

1-10	91	82	73	64	55	45	36	27	18	9
11	0									