Encontrar la expresión que muestra la distancia entre puntos Nombre:

**Determine qué expresión muestra mejor la distancia entre los dos puntos.**

**1)**

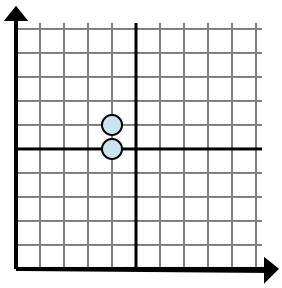

A. 6 - 5
B. 4 - 4
C. 5 - 6
D. 6 - 4

**2)**

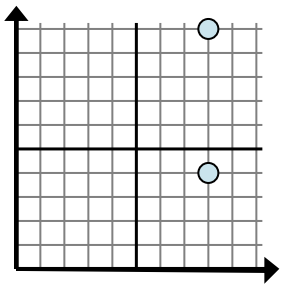

A. 4 - 10
B. 8 - 8
C. 8 - 10
D. 10 - 4

**3)**

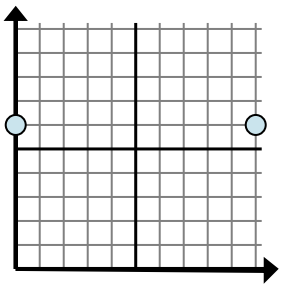

A. 10 - 0
B. 0 - 10
C. 6 - 0
D. 6 - 0

**4)**

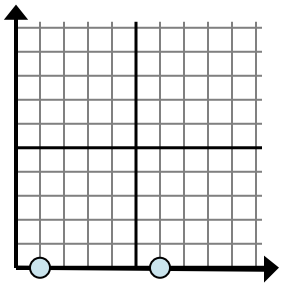

A. 0 - 0
B. 0 - 0
C. 0 - 1
D. 6 - 1

**5)**

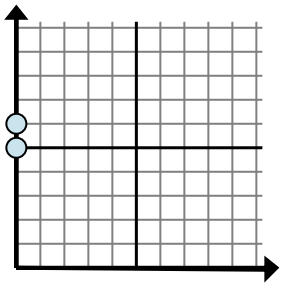

A. 0 - 6
B. 0 - 0
C. 6 - 5
D. 6 - 0

**6)**

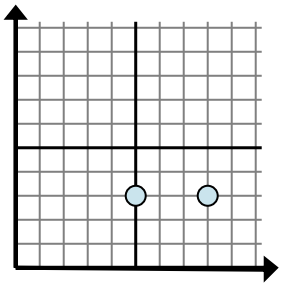

A. 3 - 8
B. 8 - 3
C. 3 - 3
D. 8 - 5

**7)**

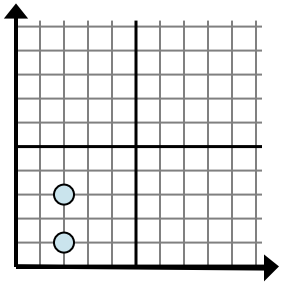

A. 2 - 2
B. 3 - 2
C. 3 - 1
D. 2 - 3

**8)**

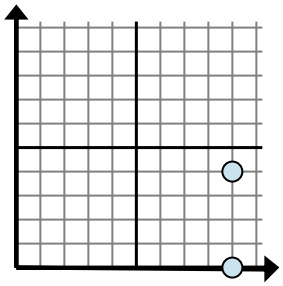

A. 0 - 4
B. 9 - 4
C. 4 - 0
D. 9 - 9

**9)**

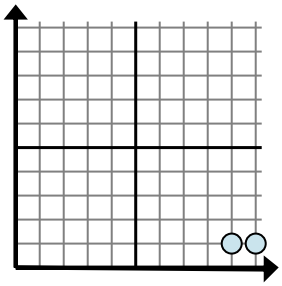

A. 1 - 9
B. 10 - 9
C. 1 - 9
D. 9 - 1

**Respuestas**

1. _____
2. _____
3. _____
4. _____
5. _____
6. _____
7. _____
8. _____
9. _____



| 1-9 | 89 | 78 | 67 | 56 | 44 | 33 | 22 | 11 | 0 |
|---|---|---|---|---|---|---|---|---|---|

Encontrar la expresión que muestra la distancia entre puntos Nombre: **Clave De Respuestas**

**Determine qué expresión muestra mejor la distancia entre los dos puntos.**

**1)**

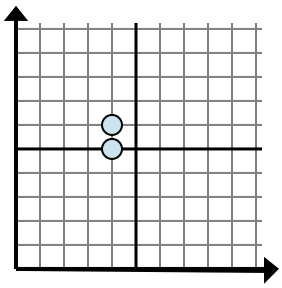

A. 6 - 5
B. 4 - 4
C. 5 - 6
D. 6 - 4

**2)**

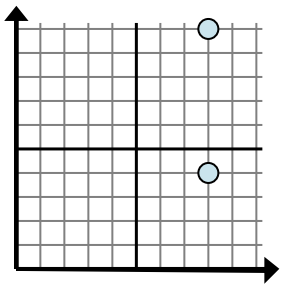

A. 4 - 10
B. 8 - 8
C. 8 - 10
D. 10 - 4

**3)**

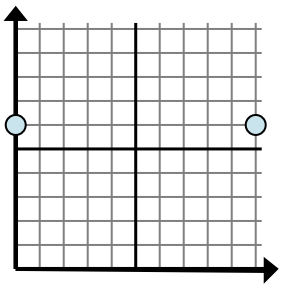

A. 10 - 0
B. 0 - 10
C. 6 - 0
D. 6 - 0

**4)**

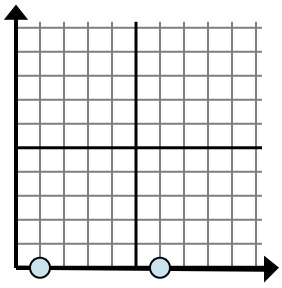

A. 0 - 0
B. 0 - 0
C. 0 - 1
D. 6 - 1

**5)**

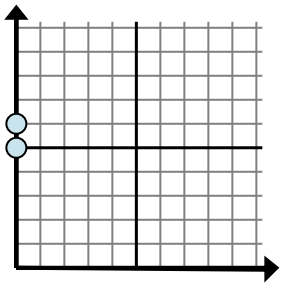

A. 0 - 6
B. 0 - 0
C. 6 - 5
D. 6 - 0

**6)**

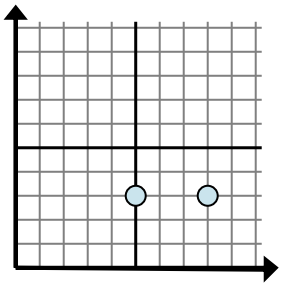

A. 3 - 8
B. 8 - 3
C. 3 - 3
D. 8 - 5

**7)**

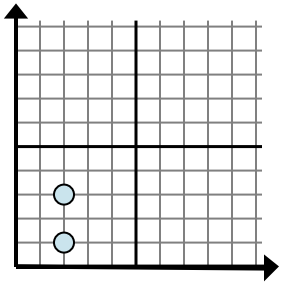

A. 2 - 2
B. 3 - 2
C. 3 - 1
D. 2 - 3

**8)**

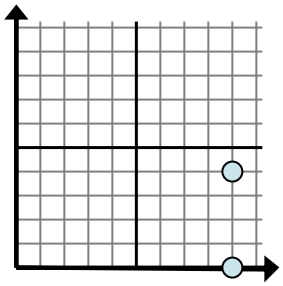

A. 0 - 4
B. 9 - 4
C. 4 - 0
D. 9 - 9

**9)**

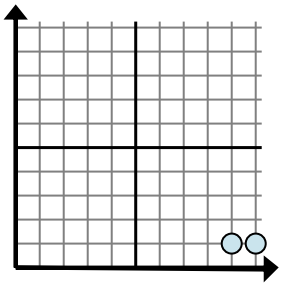

A. 1 - 9
B. 10 - 9
C. 1 - 9
D. 9 - 1

## Respuestas

1. **A**
2. **D**
3. **A**
4. **D**
5. **C**
6. **D**
7. **C**
8. **C**
9. **B**



| 1-9 | 89 | 78 | 67 | 56 | 44 | 33 | 22 | 11 | 0 |
|---|---|---|---|---|---|---|---|---|---|