Máquinas de Funciones - (Sumar y Restar) Nombre:

Determina la regla que cada máquina de función está usando.

Ej)

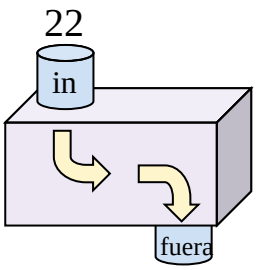

Agregar 20

1)

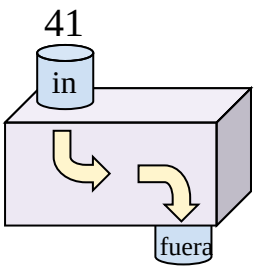

2)

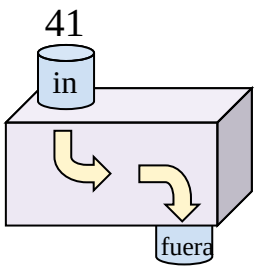

3)

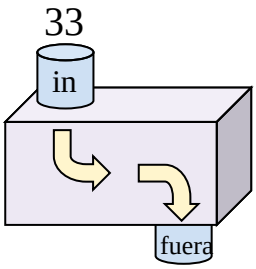

4)

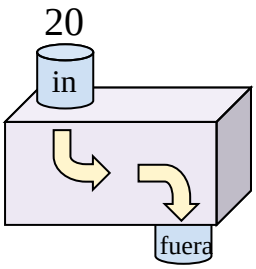

5)

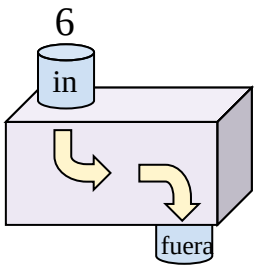

6)

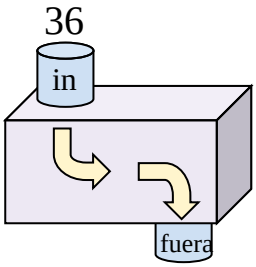

7)

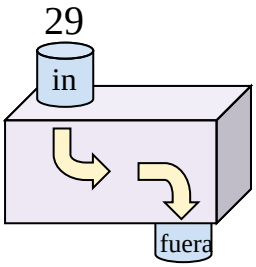

8)

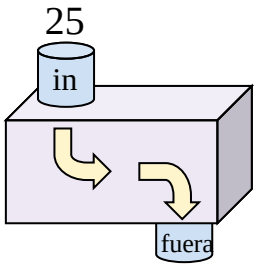

9)

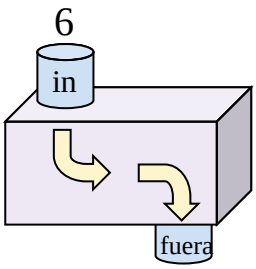

10)

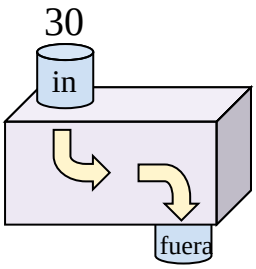

11)

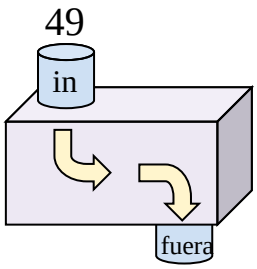

Respuestas

Ej. Agregar 20

1. _____
2. _____
3. _____
4. _____
5. _____
6. _____
7. _____
8. _____
9. _____
10. _____
11. _____

1-10	91	82	73	64	55	45	36	27	18	9
11	0									

Determina la regla que cada máquina de función está usando.

Ej)

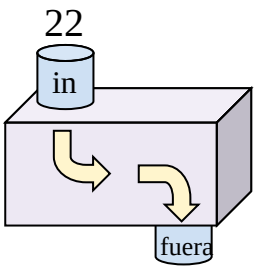

Agregar 20

1)

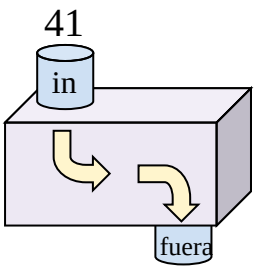

Restar 18

2)

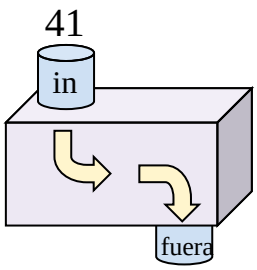

Restar 33

3)

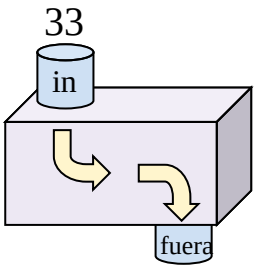

Restar 16

4)

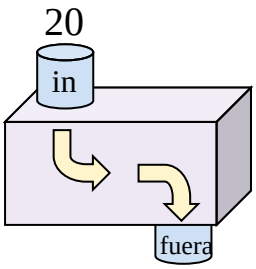

Restar 8

5)

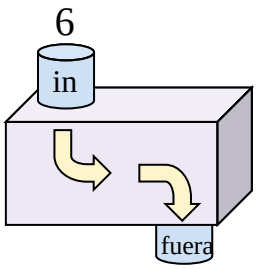

Agregar 37

6)

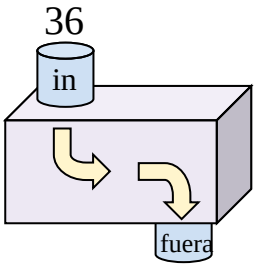

Restar 11

7)

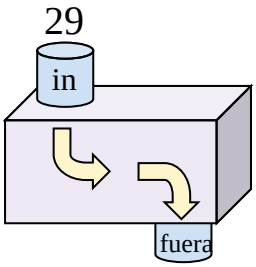

Agregar 15

8)

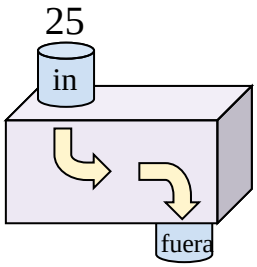

Agregar 25

9)

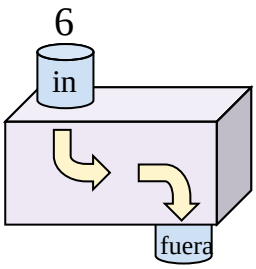

Agregar 10

10)

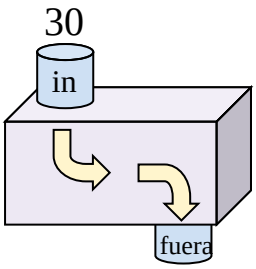

Restar 16

11)

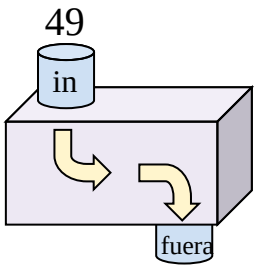

Restar 29

Respuestas

Ej. **Agregar 20**

1. **Restar 18**
2. **Restar 33**
3. **Restar 16**
4. **Restar 8**
5. **Agregar 37**
6. **Restar 11**
7. **Agregar 15**
8. **Agregar 25**
9. **Agregar 10**
10. **Restar 16**
11. **Restar 29**

1-10	91	82	73	64	55	45	36	27	18	9
11	0									