Máquinas de Funciones - (Sumar y Restar) Nombre:

Determina la regla que cada máquina de función está usando.

Ej)

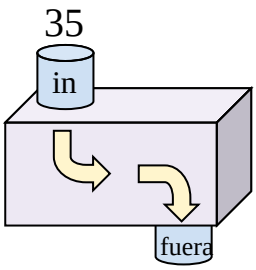

Restar 13

1)

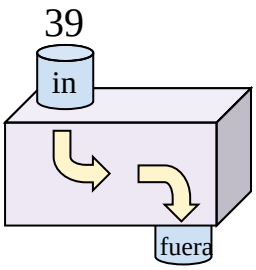

2)

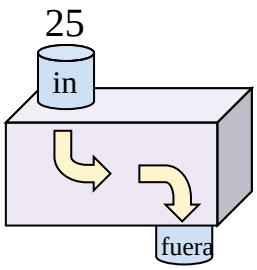

3)

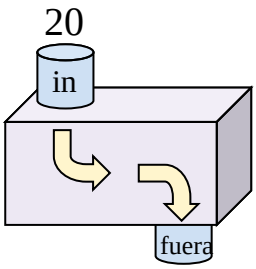

4)

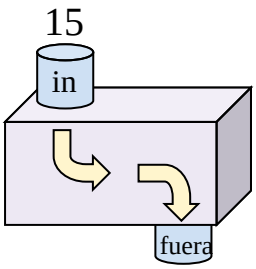

5)

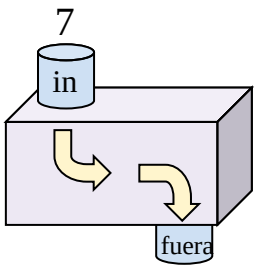

6)

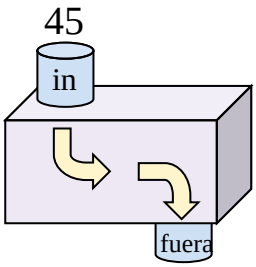

7)

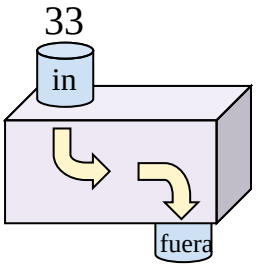

8)

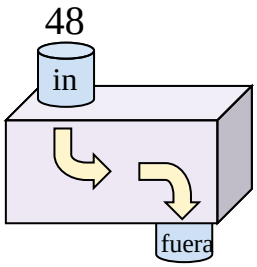

9)

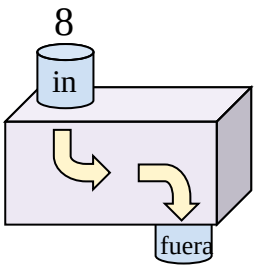

10)

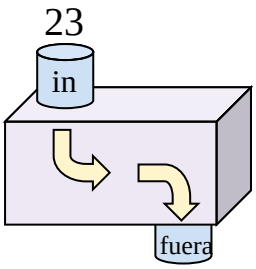

11)

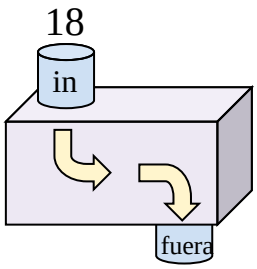

Respuestas

Ej. Restar 13

1. _____
2. _____
3. _____
4. _____
5. _____
6. _____
7. _____
8. _____
9. _____
10. _____
11. _____

1-10	91	82	73	64	55	45	36	27	18	9
11	0									

Determina la regla que cada máquina de función está usando.

Ej)

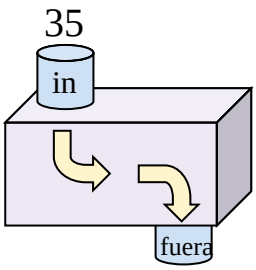

Restar 13

1)

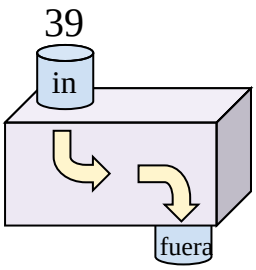

Restar 31

2)

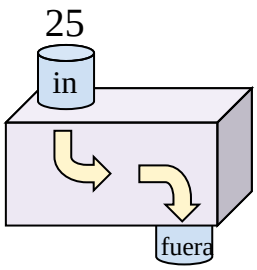

Agregar 10

3)

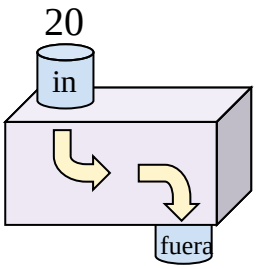

Agregar 8

4)

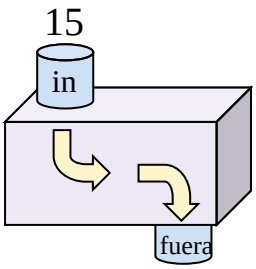

Agregar 34

5)

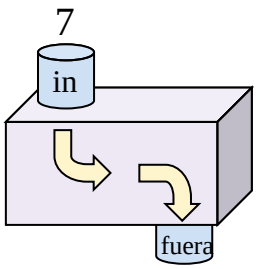

Agregar 21

6)

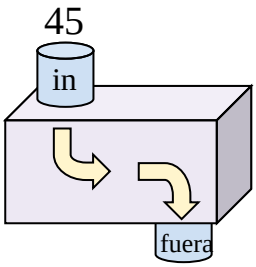

Restar 21

7)

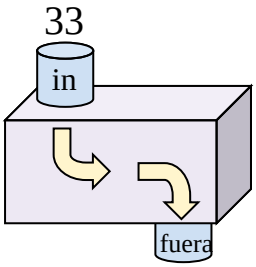

Restar 13

8)

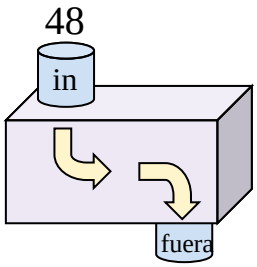

Restar 28

9)

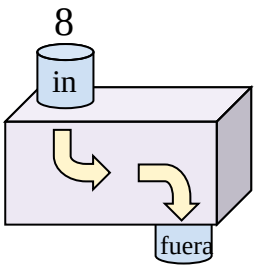

Agregar 38

10)

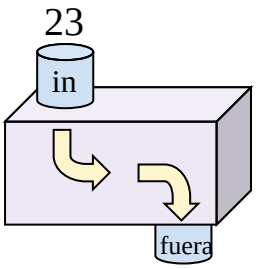

Agregar 12

11)

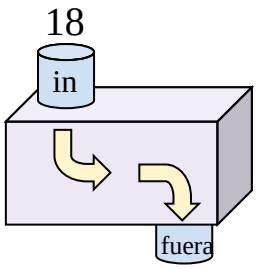

Agregar 6

Respuestas

Ej. **Restar 13**

1. **Restar 31**
2. **Agregar 10**
3. **Agregar 8**
4. **Agregar 34**
5. **Agregar 21**
6. **Restar 21**
7. **Restar 13**
8. **Restar 28**
9. **Agregar 38**
10. **Agregar 12**
11. **Agregar 6**

1-10	91	82	73	64	55	45	36	27	18	9
11	0									