Creación de figuras Nombre:

Determine qué letra representa MEJOR las formas que se utilizaron para crear la figura que se muestra.

1)

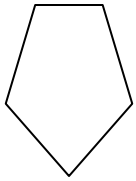

A. hexágono & triangle
B. cuadrilátero & triangle
C. rectangle & pentágono
D. rectangle & octágonos

2)

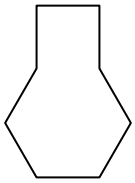

A. pentágono & square
B. square & heptágono
C. hexágono & square
D. square & triangle

3)



A. cuadrilátero & triangle
B. square & cuadrilátero
C. heptágono & octágonos
D. hexágono & heptágono

4)

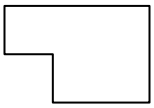

A. rectangle & square
B. hexágono & square
C. cuadrilátero & octágonos
D. rectangle & triangle

5)

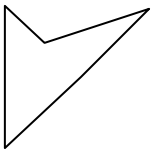

A. triangle & triangle
B. rectangle & hexágono
C. pentágono & cuadrilátero
D. rectangle & cuadrilátero

6)

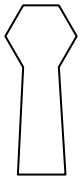

A. cuadrilátero & hexágono
B. cuadrilátero & heptágono
C. hexágono & cuadrilátero
D. cuadrilátero & triangle

7)

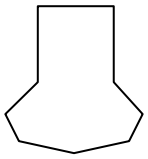

A. heptágono & rectangle
B. square & rectangle
C. heptágono & cuadrilátero
D. pentágono & octágonos

8)

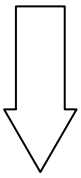

A. hexágono & octágonos
B. octágonos & square
C. triangle & pentágono
D. rectangle & triangle

Respuestas

1. _____
2. _____
3. _____
4. _____
5. _____
6. _____
7. _____
8. _____

1-8	88	75	63	50	38	25	13	0

Determine qué letra representa MEJOR las formas que se utilizaron para crear la figura que se muestra.

1)

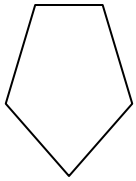

A. hexágono & triangle
B. cuadrilátero & triangle
C. rectangle & pentágono
D. rectangle & octágonos

2)

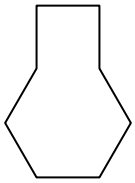

A. pentágono & square
B. square & heptágono
C. hexágono & square
D. square & triangle

3)



A. cuadrilátero & triangle
B. square & cuadrilátero
C. heptágono & octágonos
D. hexágono & heptágono

4)

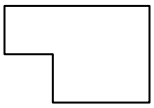

A. rectangle & square
B. hexágono & square
C. cuadrilátero & octágonos
D. rectangle & triangle

5)

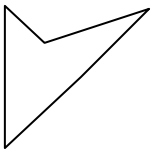

A. triangle & triangle
B. rectangle & hexágono
C. pentágono & cuadrilátero
D. rectangle & cuadrilátero

6)

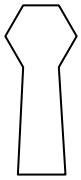

A. cuadrilátero & hexágono
B. cuadrilátero & heptágono
C. hexágono & cuadrilátero
D. cuadrilátero & triangle

7)

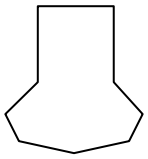

A. heptágono & rectangle
B. square & rectangle
C. heptágono & cuadrilátero
D. pentágono & octágonos

8)

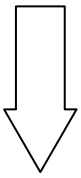

A. hexágono & octágonos
B. octágonos & square
C. triangle & pentágono
D. rectangle & triangle

Respuestas

1. **B**
2. **C**
3. **A**
4. **A**
5. **A**
6. **C**
7. **C**
8. **D**

1-8	88	75	63	50	38	25	13	0