Determinando la transformación de las figuras Nombre:

Determinar si la figura se está trasladando (deslizando), rotando (girando) o reflejando (volteando)

1)

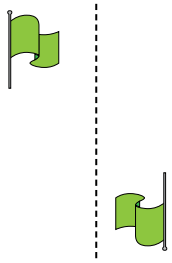

2)



3)

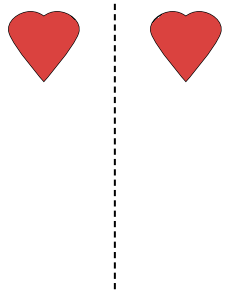

4)

5)



6)

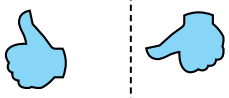

7)

8)

9)

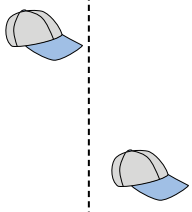

10)

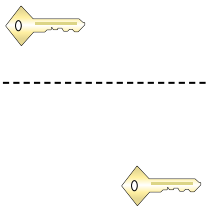

11)



12)

13)

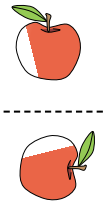

14)

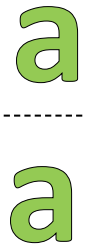

15)



Respuestas

1. _____
2. _____
3. _____
4. _____
5. _____
6. _____
7. _____
8. _____
9. _____
10. _____
11. _____
12. _____
13. _____
14. _____
15. _____

1-10	93	87	80	73	67	60	53	47	40	33
11-15	27	20	13	7	0					

Determinando la transformación de las figuras

Nombre: **Clave De Respuestas**

Determinar si la figura se está trasladando (deslizando), rotando (girando) o reflejando (volteando)

1)

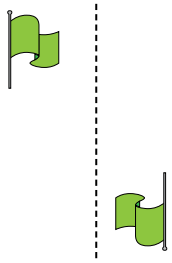

2)



3)

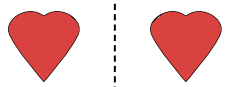

4)

5)



6)

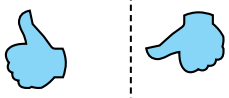

7)

8)

9)

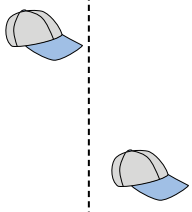

10)

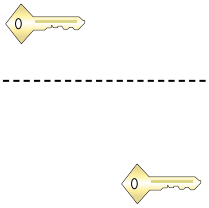

11)



12)

13)

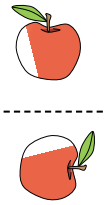

14)

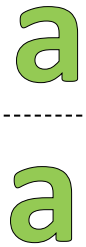

15)



Respuestas

1. girando
2. volteando
3. volteando
4. volteando
5. deslizando
6. girando
7. deslizando
8. volteando
9. deslizando
10. deslizando
11. volteando
12. girando
13. girando
14. deslizando
15. girando

1-10	93	87	80	73	67	60	53	47	40	33
11-15	27	20	13	7	0					