Determinación de la simetría

Nombre:

Determinar si la línea a través de cada figura es una línea de simetría.

Ej)

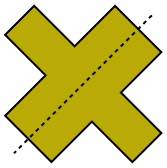

1)

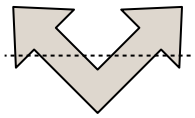

2)

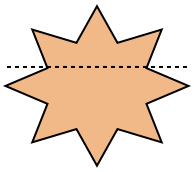

3)

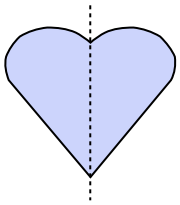

4)

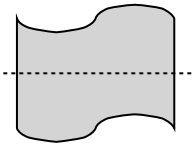

5)

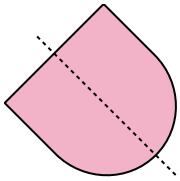

6)

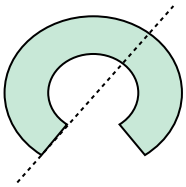

7)

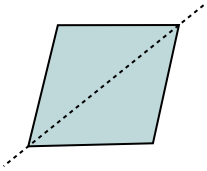

8)

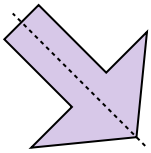

9)

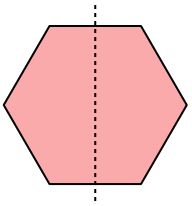

10)

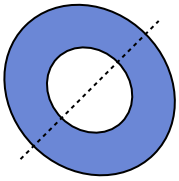

11)

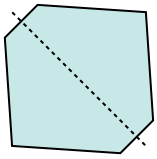

Respuestas

Ej. si

1. _____
2. _____
3. _____
4. _____
5. _____
6. _____
7. _____
8. _____
9. _____
10. _____
11. _____

1-10	91	82	73	64	55	45	36	27	18	9
11	0									

Determinar si la línea a través de cada figura es una línea de simetría.

Ej)

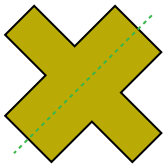

1)

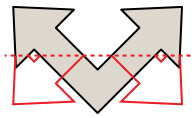

2)

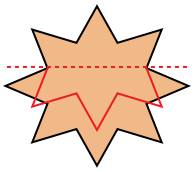

3)

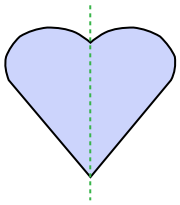

4)

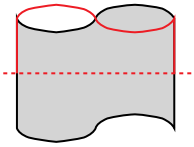

5)

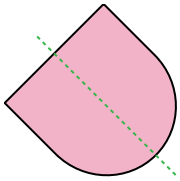

6)

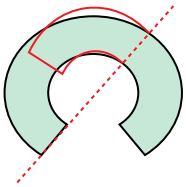

7)

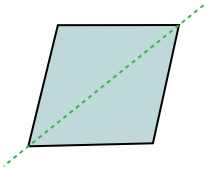

8)

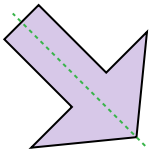

9)

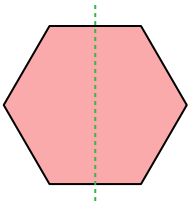

10)

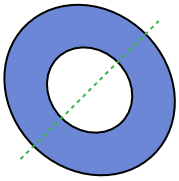

11)

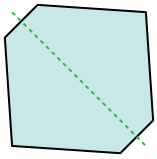

Respuestas

Ej.	si
1.	no
2.	no
3.	si
4.	no
5.	si
6.	no
7.	si
8.	si
9.	si
10.	si
11.	si

1-10	91	82	73	64	55	45	36	27	18	9
11	0									